Determinación del valor con bloques

Nombre:

Encontrar el valor que cada conjunto de bloques representa.

1) 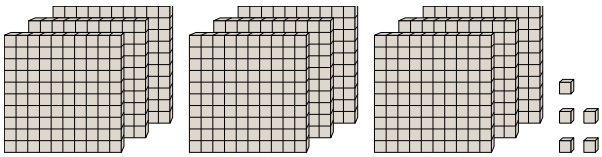

2) 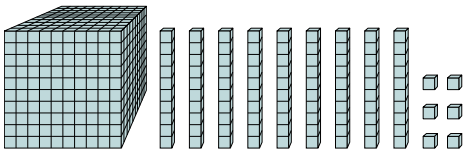

3) 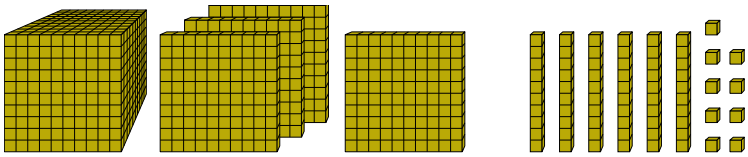

4) 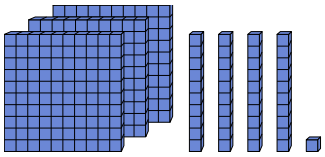

5) 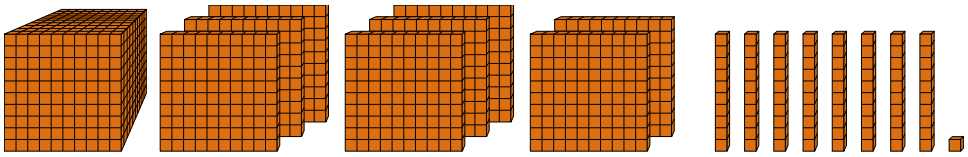

6) 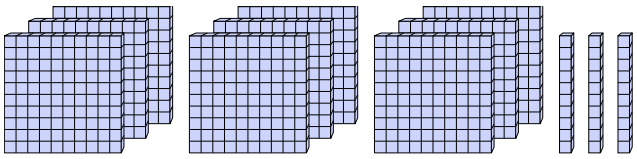

7) 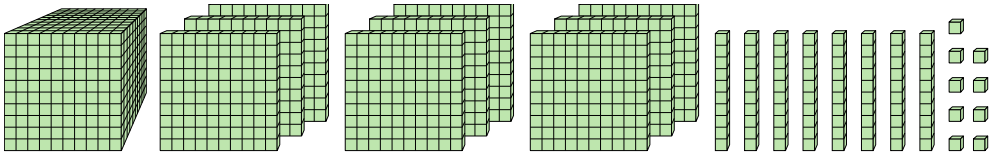

8) 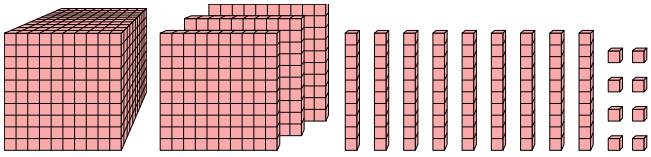

9) 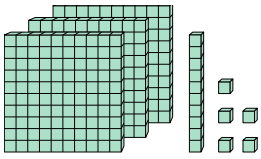

10) 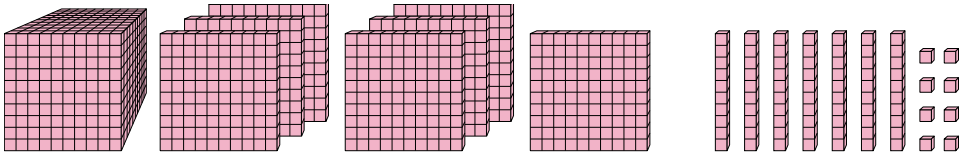

Respuestas

1. _____
2. _____
3. _____
4. _____
5. _____
6. _____
7. _____
8. _____
9. _____
10. _____

1-10	90	80	70	60	50	40	30	20	10	0

Determinación del valor con bloques

Nombre: **Clave De Respuestas**

Encontrar el valor que cada conjunto de bloques representa.

1) 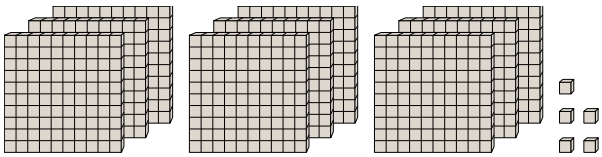

2) 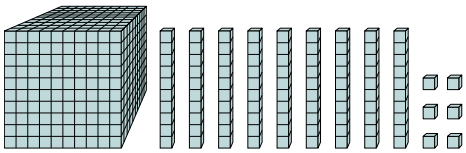

3) 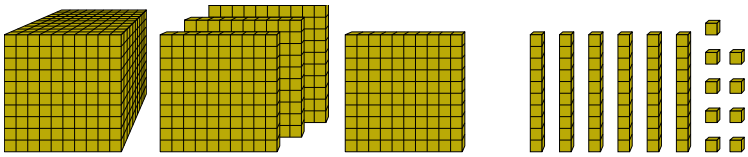

4) 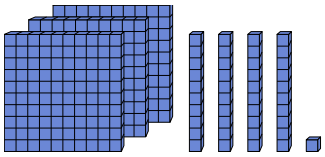

5) 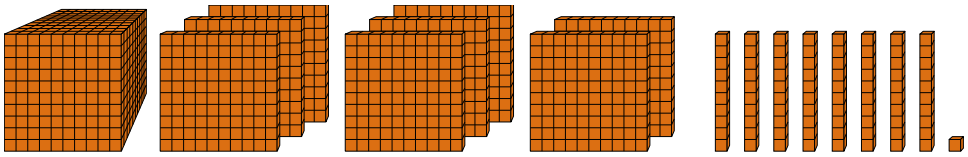

6) 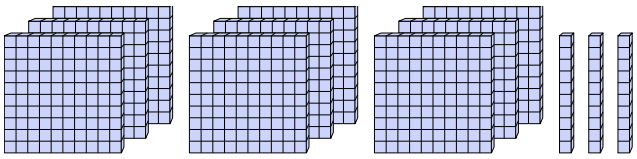

7) 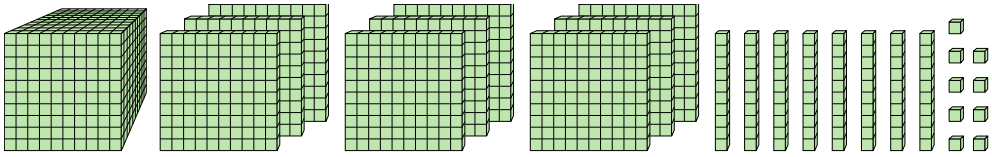

8) 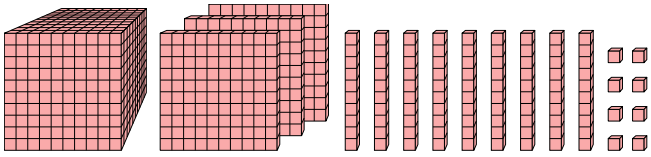

9) 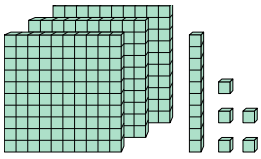

10) 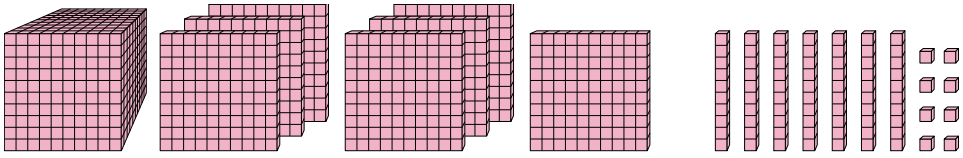

Respuestas

1. **905**
2. **1,096**
3. **1,469**
4. **341**
5. **1,881**
6. **930**
7. **1,989**
8. **1,398**
9. **315**
10. **1,778**

1-10	90	80	70	60	50	40	30	20	10	0