Identificando Figuras Regulares e Irregulares Nombre:

Determinar si la figura mostrada es una forma regular o irregular.

1)

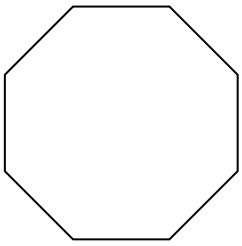

2)



3)

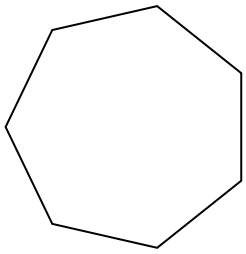

4)



5)

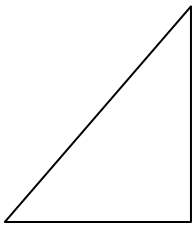

6)

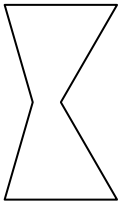

7)

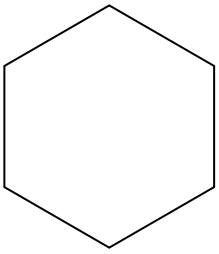

8)

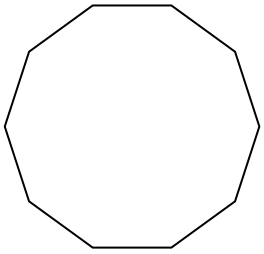

9)



10)

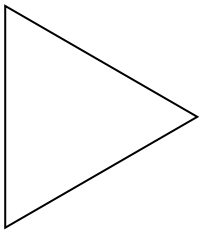

11)



12)

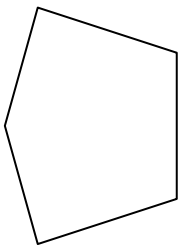

13)



14)

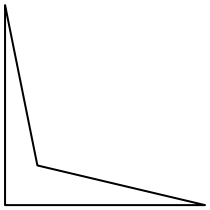

15)

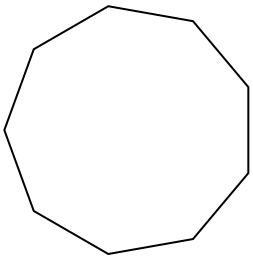

Respuestas

1. _____
2. _____
3. _____
4. _____
5. _____
6. _____
7. _____
8. _____
9. _____
10. _____
11. _____
12. _____
13. _____
14. _____
15. _____

1-10	93	87	80	73	67	60	53	47	40	33
11-15	27	20	13	7	0					

Determinar si la figura mostrada es una forma regular o irregular.

1)

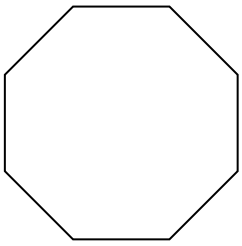

2)



3)

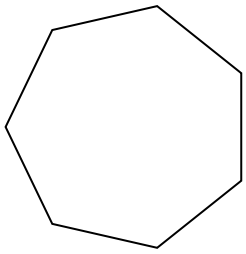

4)



5)

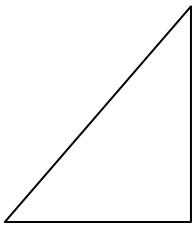

6)

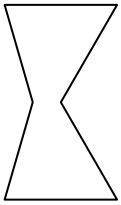

7)

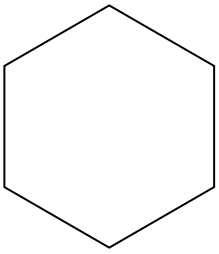

8)

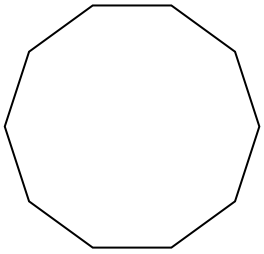

9)



10)

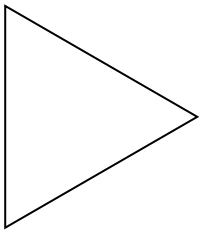

11)



12)

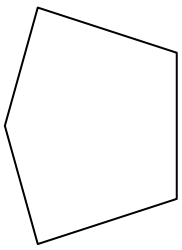

13)



14)

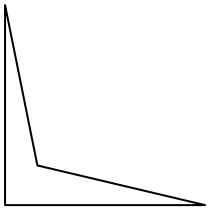

15)

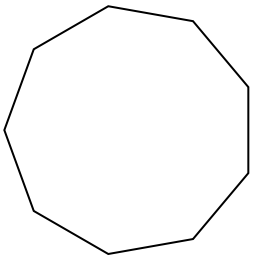

Respuestas

1. Regulare
2. Irregulare
3. Regulare
4. Irregulare
5. Irregulare
6. Irregulare
7. Regulare
8. Regulare
9. Irregulare
10. Regulare
11. Regulare
12. Irregulare
13. Irregulare
14. Irregulare
15. Regulare

1-10	93	87	80	73	67	60	53	47	40	33
11-15	27	20	13	7	0					