Identificando figuras irregulares

Nombre:

Identificar el tipo de figura mostrada.

1)

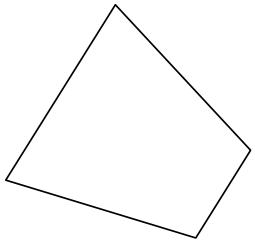

2)

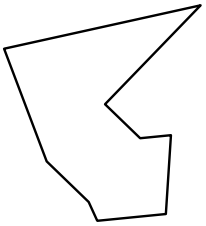

3)

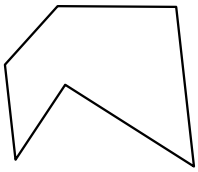

4)



5)



6)

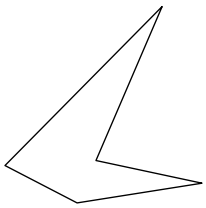

7)

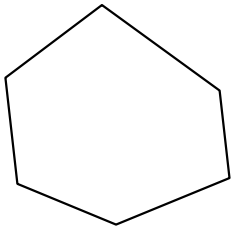

8)

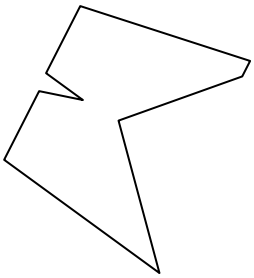

9)

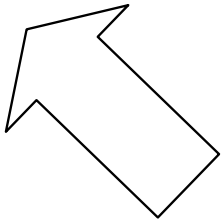

10)

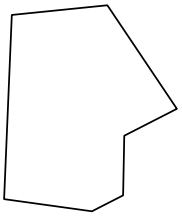

11)

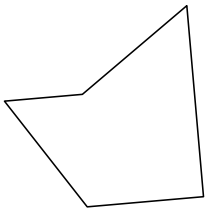

12)

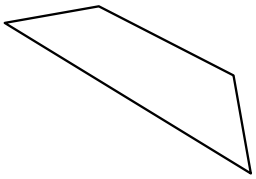

13)

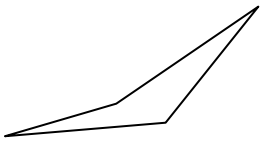

14)

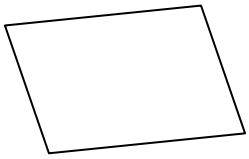

15)



16)

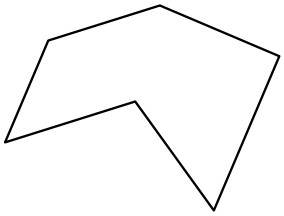

17)

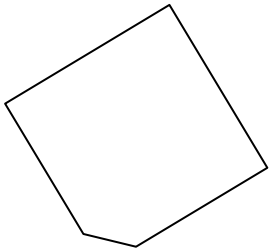

18)

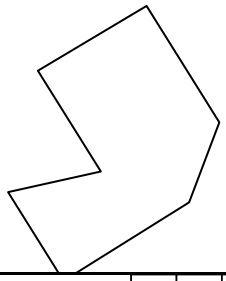

Respuestas

1. _____
2. _____
3. _____
4. _____
5. _____
6. _____
7. _____
8. _____
9. _____
10. _____
11. _____
12. _____
13. _____
14. _____
15. _____
16. _____
17. _____
18. _____
19. _____
20. _____
21.

1-10	93	87	80	73	67	60	53	47	40	33
11-15	27	20	13	7	0					

Identificar el tipo de figura mostrada.

1)

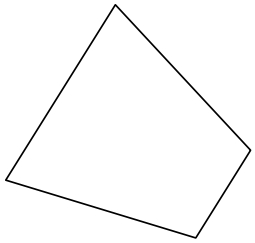

2)

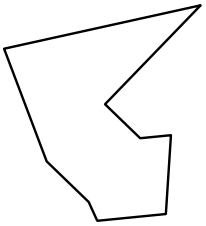

3)

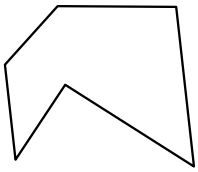

4)



5)



6)

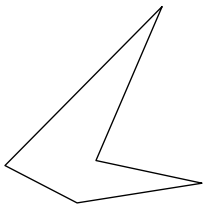

7)

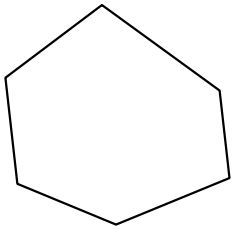

8)

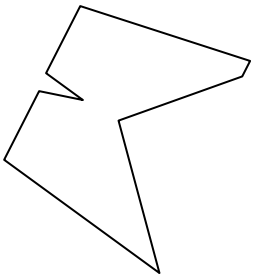

9)

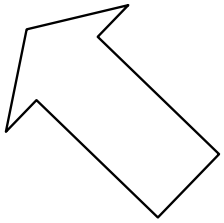

10)

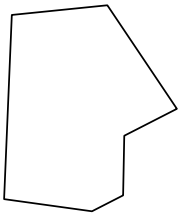

11)

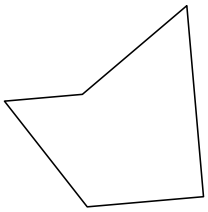

12)

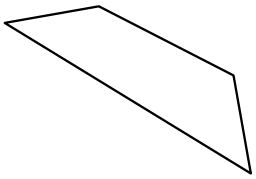

13)

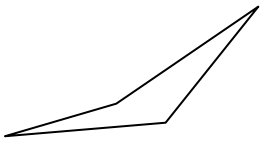

14)

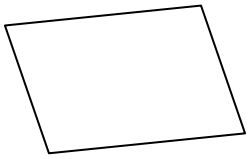

15)



16)

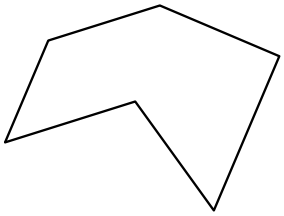

17)

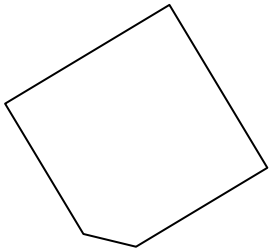

18)

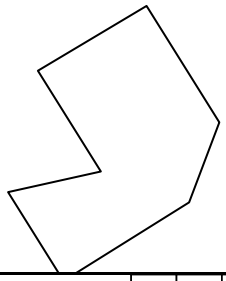

Respuestas

1. cuadrilátero
2. nonagono
3. hexágono
4. pentágono
5. decágono
6. pentágono
7. hexágono
8. nonagono
9. heptágono
10. heptágono
11. pentágono
12. cuadrilátero
13. cuadrilátero
14. cuadrilátero
15. heptágono
16. hexágono
17. pentágono
18. heptágono
19. heptágono
20. octágonos
21. hexágono

1-10	93	87	80	73	67	60	53	47	40	33
11-15	27	20	13	7	0					