Emparejando Desigualdades a Líneas de Números

Nombre:

Resuelve cada problema.

1) ¿Qué opción representa mejor X < -5

A.

B.

C.

D.

2) ¿Qué opción representa mejor X < -4

A. 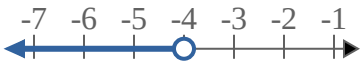

B.

C.

D.

3) ¿Qué opción representa mejor X < -8

A.

B.

C. 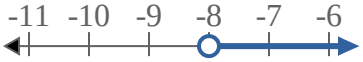

D.

4) ¿Qué opción representa mejor X < -1

A.

B.

C.

D.

5) ¿Qué opción representa mejor X ≥ 11

A.

B.

C. 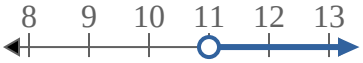

D.

6) ¿Qué opción representa mejor X ≥ 5

A.

B.

C.

D. 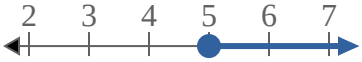

7) ¿Qué opción representa mejor X ≥ 13

A.

B. 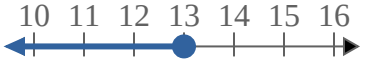

C.

D. 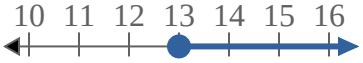

8) ¿Qué opción representa mejor X < 2

A.

B.

C.

D.

Respuestas

1. _____
2. _____
3. _____
4. _____
5. _____
6. _____
7. _____
8. _____

1-8	88	75	63	50	38	25	13	0

Emparejando Desigualdades a Líneas de Números Nombre: **Clave De Respuestas**

Resuelve cada problema.

1) ¿Qué opción representa mejor X < -5

A.

B.

C.

D. 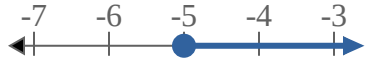

2) ¿Qué opción representa mejor X < -4

A. 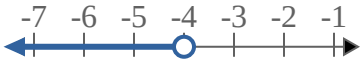

B.

C. 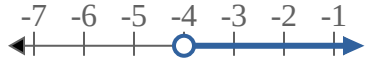

D.

3) ¿Qué opción representa mejor X < -8

A.

B.

C.

D.

4) ¿Qué opción representa mejor X < -1

A.

B.

C.

D.

5) ¿Qué opción representa mejor X ≥ 11

A.

B.

C. 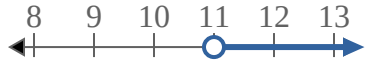

D.

6) ¿Qué opción representa mejor X ≥ 5

A.

B.

C.

D.

7) ¿Qué opción representa mejor X ≥ 13

A. 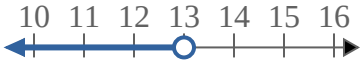

B. 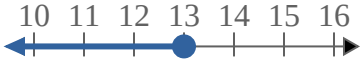

C.

D. 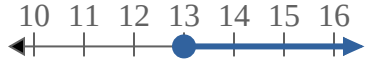

8) ¿Qué opción representa mejor X < 2

A.

B.

C.

D.

Respuestas

1. A
2. A
3. A
4. A
5. D
6. D
7. D
8. A

1-8	88	75	63	50	38	25	13	0

Emparejando Desigualdades a Líneas de Números

Nombre:

Resuelve cada problema.

1) ¿Qué opción representa mejor X < -6

A.

B.

C.

D.

2) ¿Qué opción representa mejor X < 8

A.

B. 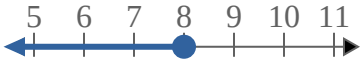

C. 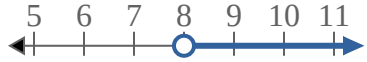

D. 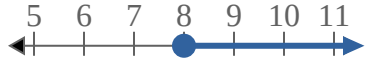

3) ¿Qué opción representa mejor X ≤ 5

A.

B. 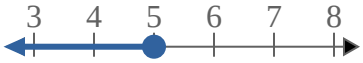

C.

D.

4) ¿Qué opción representa mejor X ≥ -12

A. 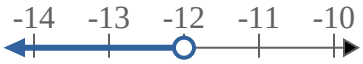

B. 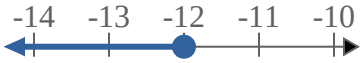

C. 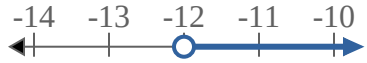

D. 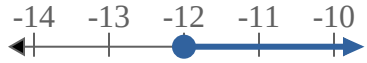

5) ¿Qué opción representa mejor X ≥ -18

A.

B.

C.

D.

6) ¿Qué opción representa mejor X ≥ -8

A.

B.

C.

D.

7) ¿Qué opción representa mejor X < 3

A.

B. 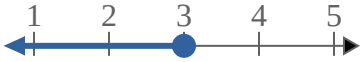

C.

D. 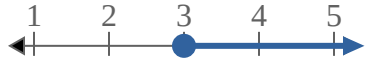

8) ¿Qué opción representa mejor X < -13

A.

B.

C.

D. 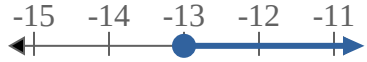

Respuestas

1. _____
2. _____
3. _____
4. _____
5. _____
6. _____
7. _____
8. _____

1-8	88	75	63	50	38	25	13	0

Resuelve cada problema.

1) ¿Qué opción representa mejor X < -6

A.

B.

C.

D.

2) ¿Qué opción representa mejor X < 8

A.

B. 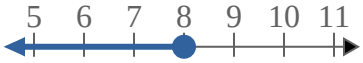

C. 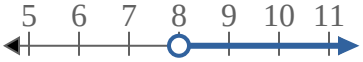

D. 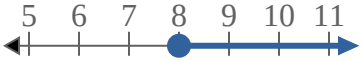

3) ¿Qué opción representa mejor X ≤ 5

A.

B.

C.

D.

4) ¿Qué opción representa mejor X ≥ -12

A. 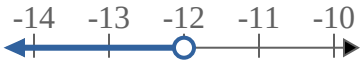

B. 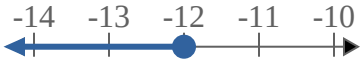

C. 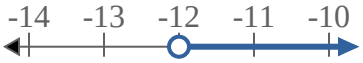

D. 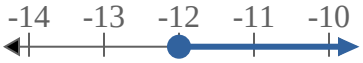

5) ¿Qué opción representa mejor X ≥ -18

A.

B.

C. 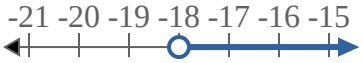

D.

6) ¿Qué opción representa mejor X ≥ -8

A.

B.

C. 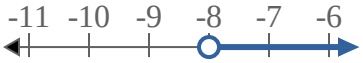

D.

7) ¿Qué opción representa mejor X < 3

A.

B. 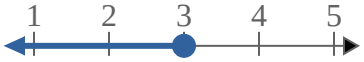

C. 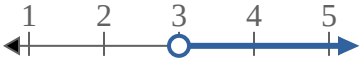

D. 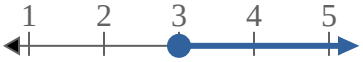

8) ¿Qué opción representa mejor X < -13

A.

B.

C.

D.

Respuestas

1. **A**
2. **A**
3. **B**
4. **D**
5. **D**
6. **D**
7. **A**
8. **A**

1-8	88	75	63	50	38	25	13	0

Emparejando Desigualdades a Líneas de Números

Nombre:

Resuelve cada problema.

1) ¿Qué opción representa mejor X < 20

A.

B. 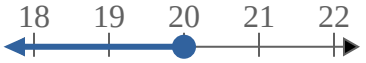

C.

D.

2) ¿Qué opción representa mejor X ≥ -5

A.

B.

C.

D.

3) ¿Qué opción representa mejor X ≤ -8

A. 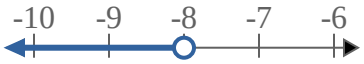

B.

C. 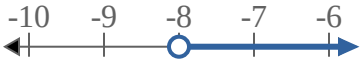

D. 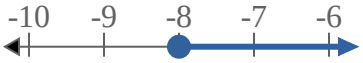

4) ¿Qué opción representa mejor X ≥ 6

A.

B. 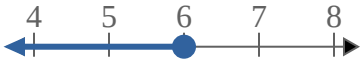

C.

D. 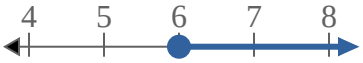

5) ¿Qué opción representa mejor X > -1

A.

B.

C.

D.

6) ¿Qué opción representa mejor X ≤ 6

A.

B. 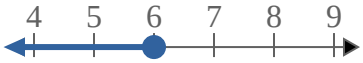

C.

D.

7) ¿Qué opción representa mejor X < 9

A.

B.

C.

D.

8) ¿Qué opción representa mejor X ≤ -11

A.

B.

C. 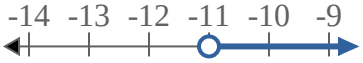

D. 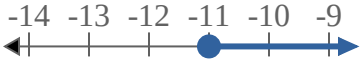

Respuestas

1. _____
2. _____
3. _____
4. _____
5. _____
6. _____
7. _____
8. _____

1-8	88	75	63	50	38	25	13	0

Resuelve cada problema.

1) ¿Qué opción representa mejor X < 20

A.

B. 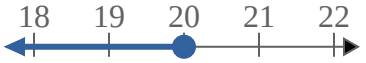

C.

D.

2) ¿Qué opción representa mejor X ≥ -5

A.

B.

C.

D.

3) ¿Qué opción representa mejor X ≤ -8

A. 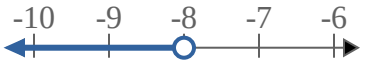

B. 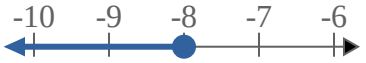

C. 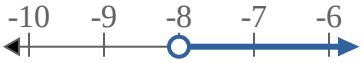

D. 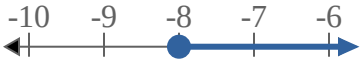

4) ¿Qué opción representa mejor X ≥ 6

A.

B. 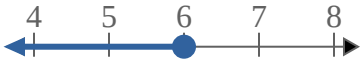

C.

D. 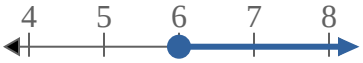

5) ¿Qué opción representa mejor X > -1

A.

B.

C.

D.

6) ¿Qué opción representa mejor X ≤ 6

A.

B. 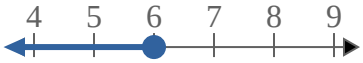

C.

D.

7) ¿Qué opción representa mejor X < 9

A. 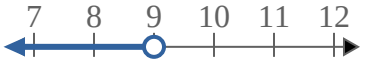

B.

C.

D.

8) ¿Qué opción representa mejor X ≤ -11

A.

B.

C. 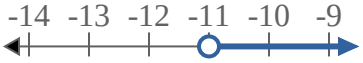

D. 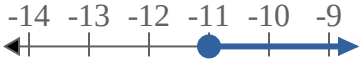

Respuestas

1. **A**
2. **D**
3. **B**
4. **D**
5. **C**
6. **B**
7. **A**
8. **B**

1-8	88	75	63	50	38	25	13	0

Emparejando Desigualdades a Líneas de Números

Nombre:

Resuelve cada problema.

1) ¿Qué opción representa mejor X < -17

A.

B.

C. 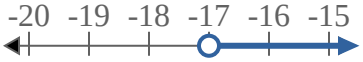

D. 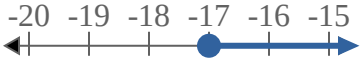

2) ¿Qué opción representa mejor X ≤ 20

A.

B. 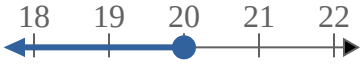

C.

D. 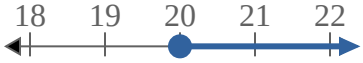

3) ¿Qué opción representa mejor X ≥ 12

A. 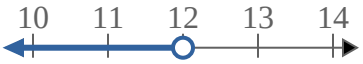

B. 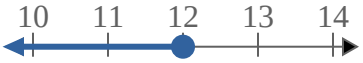

C.

D. 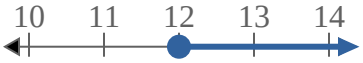

4) ¿Qué opción representa mejor X ≥ -17

A.

B.

C.

D.

5) ¿Qué opción representa mejor X ≥ 6

A.

B. 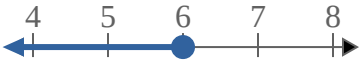

C.

D. 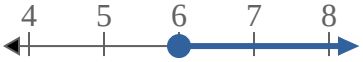

6) ¿Qué opción representa mejor X ≤ 11

A.

B.

C. 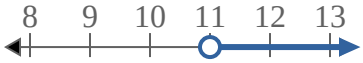

D.

7) ¿Qué opción representa mejor X ≤ -8

A. 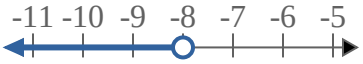

B. 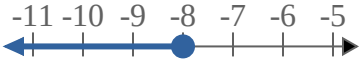

C. 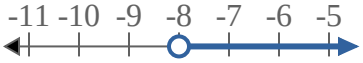

D. 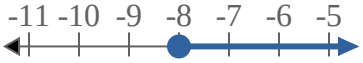

8) ¿Qué opción representa mejor X > 2

A.

B.

C.

D.

Respuestas

1. _____
2. _____
3. _____
4. _____
5. _____
6. _____
7. _____
8. _____

1-8	88	75	63	50	38	25	13	0

Resuelve cada problema.

1) ¿Qué opción representa mejor X < -17

A.

B.

C. 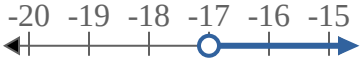

D. 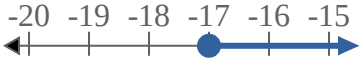

2) ¿Qué opción representa mejor X ≤ 20

A.

B. 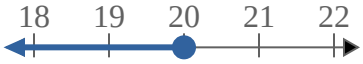

C.

D. 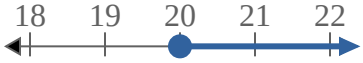

3) ¿Qué opción representa mejor X ≥ 12

A. 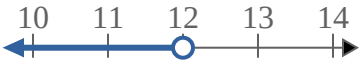

B. 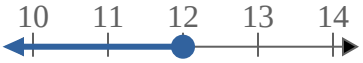

C.

D. 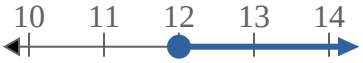

4) ¿Qué opción representa mejor X ≥ -17

A.

B.

C.

D.

5) ¿Qué opción representa mejor X ≥ 6

A.

B. 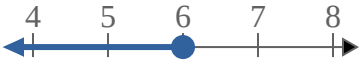

C.

D. 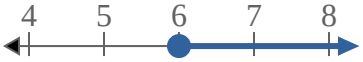

6) ¿Qué opción representa mejor X ≤ 11

A.

B.

C. 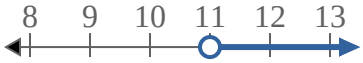

D.

7) ¿Qué opción representa mejor X ≤ -8

A. 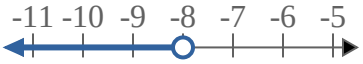

B. 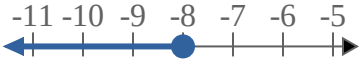

C. 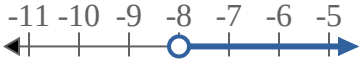

D. 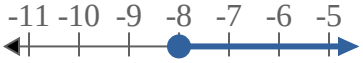

8) ¿Qué opción representa mejor X > 2

A.

B.

C.

D.

Respuestas

1. **A**
2. **B**
3. **D**
4. **D**
5. **D**
6. **B**
7. **B**
8. **C**

1-8	88	75	63	50	38	25	13	0

Emparejando Desigualdades a Líneas de Números

Nombre:

Resuelve cada problema.

1) ¿Qué opción representa mejor X > -1

A.

B.

C.

D.

2) ¿Qué opción representa mejor X < -14

A. 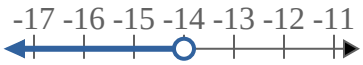

B.

C.

D.

3) ¿Qué opción representa mejor X ≤ -11

A.

B.

C. 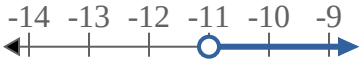

D. 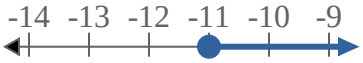

4) ¿Qué opción representa mejor X < -10

A. 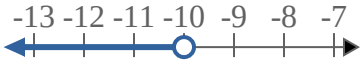

B.

C.

D. 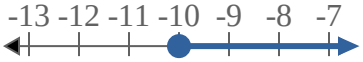

5) ¿Qué opción representa mejor X ≤ -16

A.

B.

C.

D.

6) ¿Qué opción representa mejor X > 17

A.

B.

C.

D.

7) ¿Qué opción representa mejor X > 1

A. 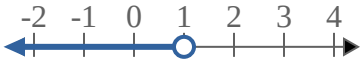

B. 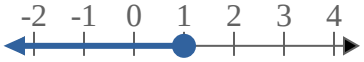

C. 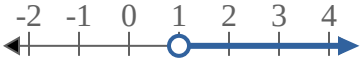

D. 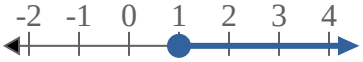

8) ¿Qué opción representa mejor X > -7

A.

B.

C.

D.

Respuestas

1. _____
2. _____
3. _____
4. _____
5. _____
6. _____
7. _____
8. _____

1-8	88	75	63	50	38	25	13	0

Resuelve cada problema.

1) ¿Qué opción representa mejor X > -1

A.

B. 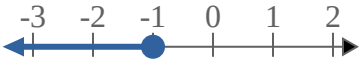

C.

D.

2) ¿Qué opción representa mejor X < -14

A. 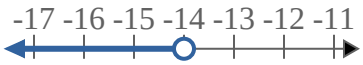

B.

C.

D.

3) ¿Qué opción representa mejor X ≤ -11

A.

B.

C. 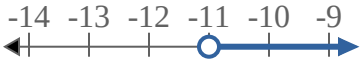

D. 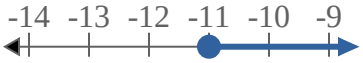

4) ¿Qué opción representa mejor X < -10

A. 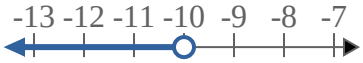

B.

C.

D. 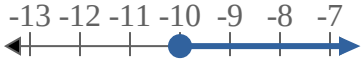

5) ¿Qué opción representa mejor X ≤ -16

A.

B.

C.

D.

6) ¿Qué opción representa mejor X > 17

A.

B.

C.

D. 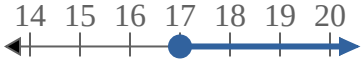

7) ¿Qué opción representa mejor X > 1

A. 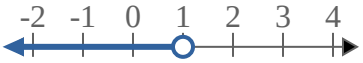

B. 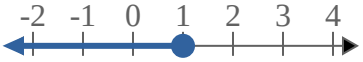

C. 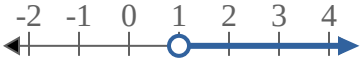

D. 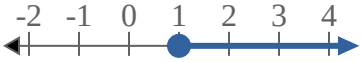

8) ¿Qué opción representa mejor X > -7

A.

B.

C.

D.

Respuestas

1. **C**
2. **A**
3. **B**
4. **A**
5. **B**
6. **C**
7. **C**
8. **C**

1-8	88	75	63	50	38	25	13	0

Emparejando Desigualdades a Líneas de Números

Nombre:

Resuelve cada problema.

1) ¿Qué opción representa mejor X ≤ -6

A.

B.

C.

D.

2) ¿Qué opción representa mejor X > -8

A.

B. 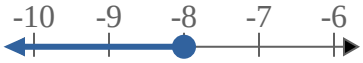

C. 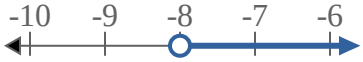

D.

3) ¿Qué opción representa mejor X < 13

A.

B.

C.

D.

4) ¿Qué opción representa mejor X < -16

A.

B.

C.

D. 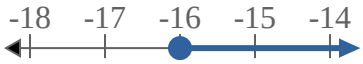

5) ¿Qué opción representa mejor X ≤ 11

A. 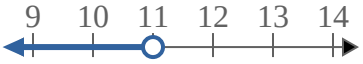

B.

C.

D.

6) ¿Qué opción representa mejor X ≥ 11

A.

B. 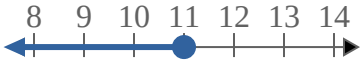

C.

D. 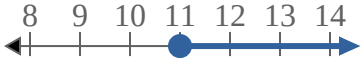

7) ¿Qué opción representa mejor X > -9

A.

B.

C.

D.

8) ¿Qué opción representa mejor X ≥ -5

A.

B.

C.

D.

Respuestas

1. _____
2. _____
3. _____
4. _____
5. _____
6. _____
7. _____
8. _____

1-8	88	75	63	50	38	25	13	0

Resuelve cada problema.

1) ¿Qué opción representa mejor X ≤ -6

A.

B.

C.

D.

2) ¿Qué opción representa mejor X > -8

A.

B. 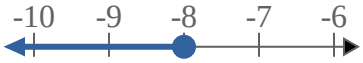

C. 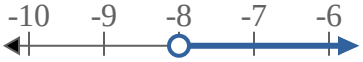

D. 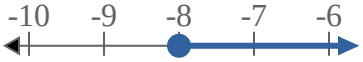

3) ¿Qué opción representa mejor X < 13

A.

B.

C.

D.

4) ¿Qué opción representa mejor X < -16

A.

B.

C.

D.

5) ¿Qué opción representa mejor X ≤ 11

A. 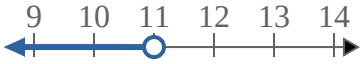

B. 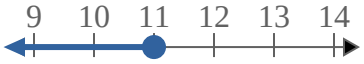

C.

D.

6) ¿Qué opción representa mejor X ≥ 11

A.

B. 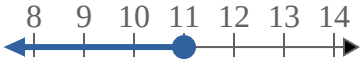

C. 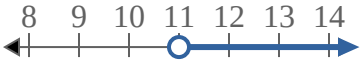

D. 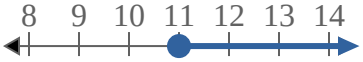

7) ¿Qué opción representa mejor X > -9

A.

B.

C.

D.

8) ¿Qué opción representa mejor X ≥ -5

A.

B.

C.

D.

Respuestas

1. **B**
2. **C**
3. **A**
4. **A**
5. **B**
6. **D**
7. **C**
8. **D**

1-8	88	75	63	50	38	25	13	0

Emparejando Desigualdades a Líneas de Números

Nombre:

Resuelve cada problema.

1) ¿Qué opción representa mejor X ≥ -1

A. 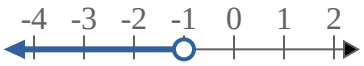

B. 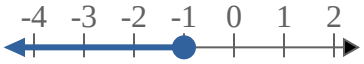

C. 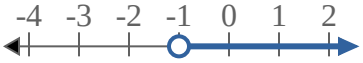

D. 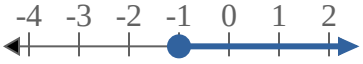

2) ¿Qué opción representa mejor X ≤ 7

A.

B.

C.

D.

3) ¿Qué opción representa mejor X > 14

A.

B.

C.

D.

4) ¿Qué opción representa mejor X > 9

A.

B. 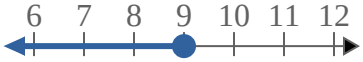

C. 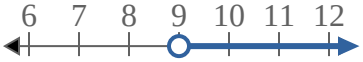

D. 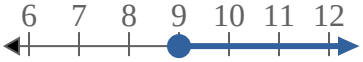

5) ¿Qué opción representa mejor X < -14

A.

B.

C.

D.

6) ¿Qué opción representa mejor X ≥ 1

A. 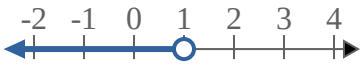

B. 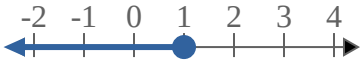

C. 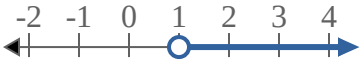

D. 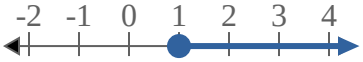

7) ¿Qué opción representa mejor X ≤ 16

A.

B. 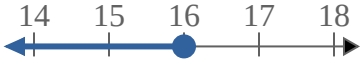

C.

D. 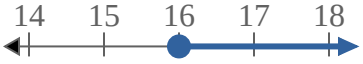

8) ¿Qué opción representa mejor X ≤ 11

A.

B.

C.

D.

Respuestas

1. _____
2. _____
3. _____
4. _____
5. _____
6. _____
7. _____
8. _____

1-8	88	75	63	50	38	25	13	0

Resuelve cada problema.

1) ¿Qué opción representa mejor X ≥ -1

A. 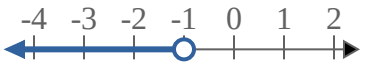

B. 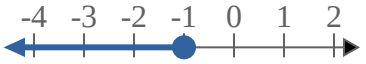

C. 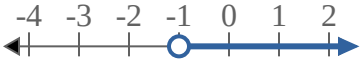

D. 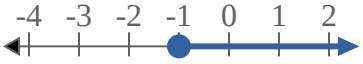

2) ¿Qué opción representa mejor X ≤ 7

A.

B.

C.

D.

3) ¿Qué opción representa mejor X > 14

A.

B.

C.

D.

4) ¿Qué opción representa mejor X > 9

A.

B. 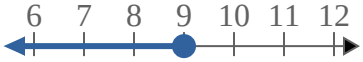

C. 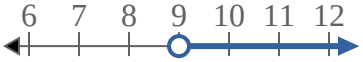

D. 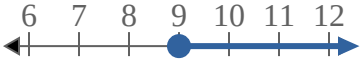

5) ¿Qué opción representa mejor X < -14

A.

B.

C.

D.

6) ¿Qué opción representa mejor X ≥ 1

A. 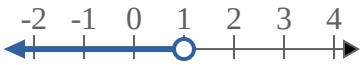

B. 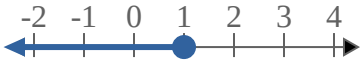

C. 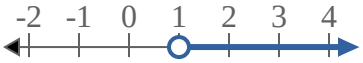

D. 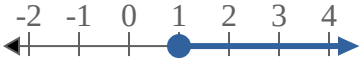

7) ¿Qué opción representa mejor X ≤ 16

A.

B. 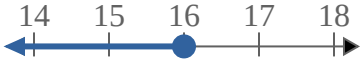

C.

D. 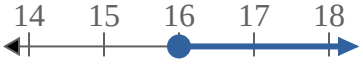

8) ¿Qué opción representa mejor X ≤ 11

A.

B.

C.

D.

Respuestas

1. **D**
2. **B**
3. **C**
4. **C**
5. **A**
6. **D**
7. **B**
8. **B**

1-8	88	75	63	50	38	25	13	0

Emparejando Desigualdades a Líneas de Números

Nombre:

Resuelve cada problema.

1) ¿Qué opción representa mejor X > -5

A.

B.

C.

D. 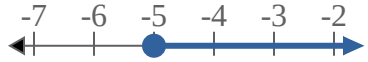

2) ¿Qué opción representa mejor X ≥ 12

A. 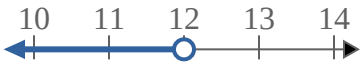

B. 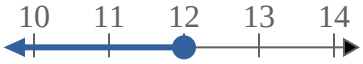

C.

D. 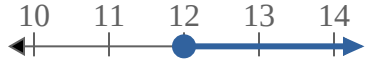

3) ¿Qué opción representa mejor X ≤ 20

A.

B. 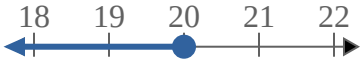

C.

D. 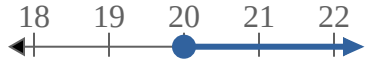

4) ¿Qué opción representa mejor X ≥ -11

A. 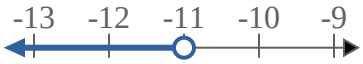

B.

C. 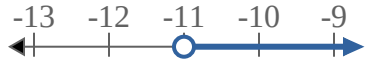

D. 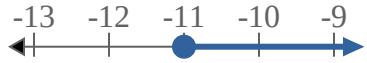

5) ¿Qué opción representa mejor X > -3

A.

B. 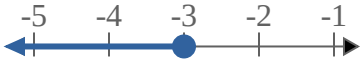

C. 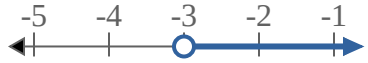

D. 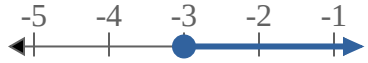

6) ¿Qué opción representa mejor X > 5

A.

B.

C.

D. 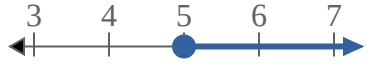

7) ¿Qué opción representa mejor X ≤ 8

A.

B. 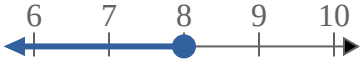

C. 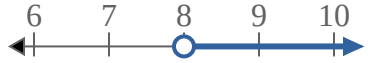

D. 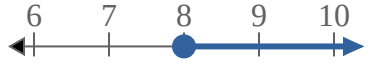

8) ¿Qué opción representa mejor X ≤ -13

A.

B.

C. 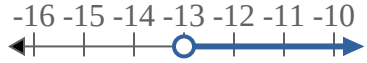

D. 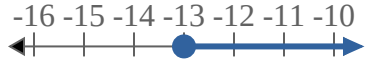

Respuestas

1. _____
2. _____
3. _____
4. _____
5. _____
6. _____
7. _____
8. _____

1-8	88	75	63	50	38	25	13	0

Resuelve cada problema.

1) ¿Qué opción representa mejor X > -5

A.

B.

C.

D. 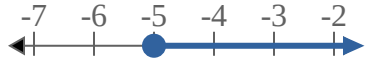

2) ¿Qué opción representa mejor X ≥ 12

A. 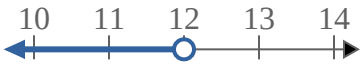

B. 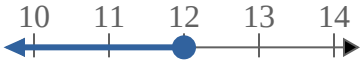

C. 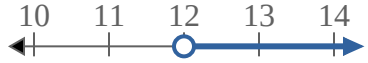

D. 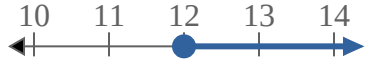

3) ¿Qué opción representa mejor X ≤ 20

A.

B. 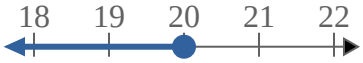

C.

D. 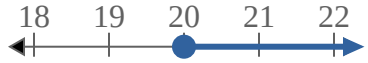

4) ¿Qué opción representa mejor X ≥ -11

A. 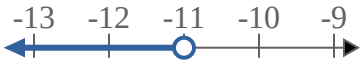

B.

C. 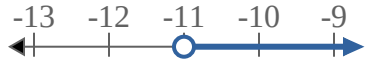

D. 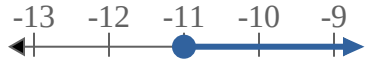

5) ¿Qué opción representa mejor X > -3

A.

B.

C.

D. 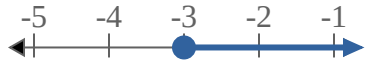

6) ¿Qué opción representa mejor X > 5

A.

B.

C.

D. 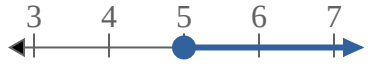

7) ¿Qué opción representa mejor X ≤ 8

A.

B.

C.

D. 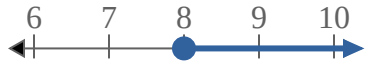

8) ¿Qué opción representa mejor X ≤ -13

A. 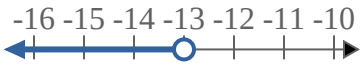

B.

C.

D.

Respuestas

1. **C**
2. **D**
3. **B**
4. **D**
5. **C**
6. **C**
7. **B**
8. **B**

1-8	88	75	63	50	38	25	13	0

Emparejando Desigualdades a Líneas de Números

Nombre:

Resuelve cada problema.

1) ¿Qué opción representa mejor X < -9

A.

B.

C. 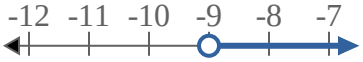

D. 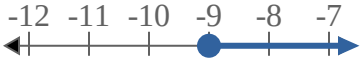

2) ¿Qué opción representa mejor X ≤ -16

A.

B.

C. 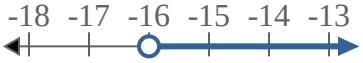

D.

3) ¿Qué opción representa mejor X ≥ -6

A.

B. 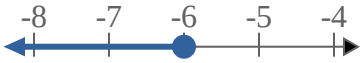

C.

D.

4) ¿Qué opción representa mejor X > -12

A. 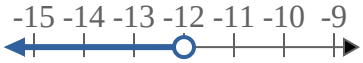

B.

C. 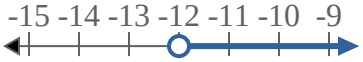

D. 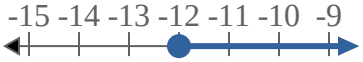

5) ¿Qué opción representa mejor X ≤ -5

A.

B.

C. 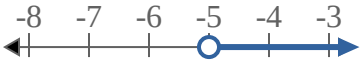

D.

6) ¿Qué opción representa mejor X < -10

A. 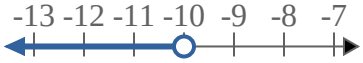

B.

C.

D. 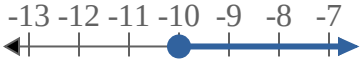

7) ¿Qué opción representa mejor X > 13

A.

B.

C. 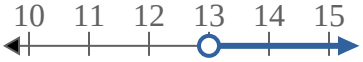

D.

8) ¿Qué opción representa mejor X < 11

A. 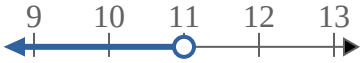

B. 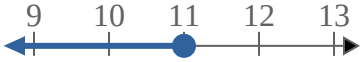

C. 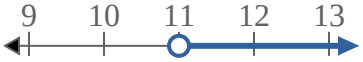

D. 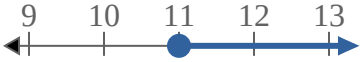

Respuestas

1. _____
2. _____
3. _____
4. _____
5. _____
6. _____
7. _____
8. _____

1-8	88	75	63	50	38	25	13	0

Resuelve cada problema.

1) ¿Qué opción representa mejor X < -9

A.

B.

C. 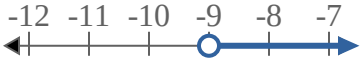

D. 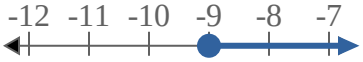

2) ¿Qué opción representa mejor X ≤ -16

A.

B.

C.

D.

3) ¿Qué opción representa mejor X ≥ -6

A.

B. 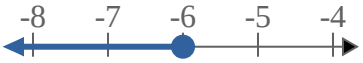

C.

D.

4) ¿Qué opción representa mejor X > -12

A. 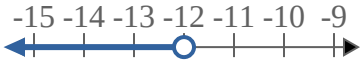

B.

C. 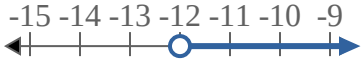

D. 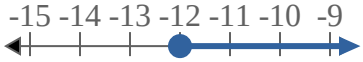

5) ¿Qué opción representa mejor X ≤ -5

A.

B.

C. 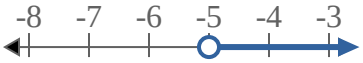

D.

6) ¿Qué opción representa mejor X < -10

A. 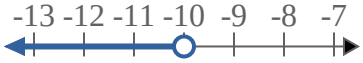

B.

C.

D. 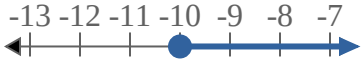

7) ¿Qué opción representa mejor X > 13

A.

B.

C. 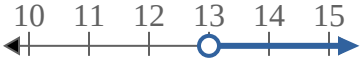

D.

8) ¿Qué opción representa mejor X < 11

A. 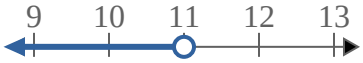

B. 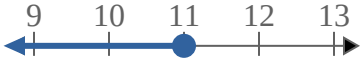

C.

D. 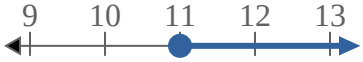

Respuestas

1. **A**
2. **B**
3. **D**
4. **C**
5. **B**
6. **A**
7. **C**
8. **A**

1-8	88	75	63	50	38	25	13	0

Emparejando Desigualdades a Líneas de Números

Nombre:

Resuelve cada problema.

1) ¿Qué opción representa mejor X ≤ 1

A.

B.

C.

D.

2) ¿Qué opción representa mejor X < -19

A. 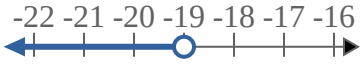

B.

C.

D.

3) ¿Qué opción representa mejor X ≥ 11

A.

B.

C. 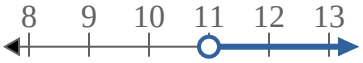

D.

4) ¿Qué opción representa mejor X ≥ -4

A.

B.

C.

D.

5) ¿Qué opción representa mejor X ≥ -1

A.

B.

C. 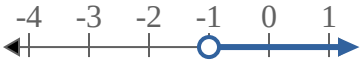

D.

6) ¿Qué opción representa mejor X ≤ -3

A.

B. 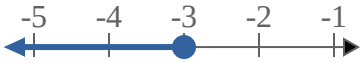

C.

D.

7) ¿Qué opción representa mejor X > -19

A.

B.

C. 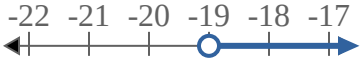

D. 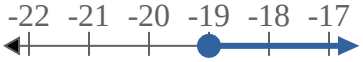

8) ¿Qué opción representa mejor X > 6

A.

B. 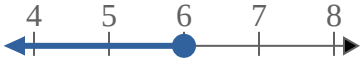

C.

D. 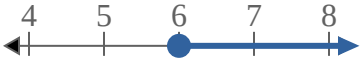

Respuestas

1. _____
2. _____
3. _____
4. _____
5. _____
6. _____
7. _____
8. _____

1-8	88	75	63	50	38	25	13	0

Emparejando Desigualdades a Líneas de Números Nombre: **Clave De Respuestas**

Resuelve cada problema.

1) ¿Qué opción representa mejor X ≤ 1

A.

B.

C.

D.

2) ¿Qué opción representa mejor X < -19

A. 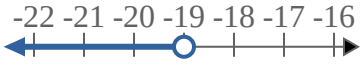

B.

C. 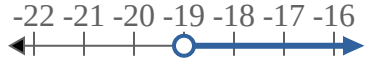

D.

3) ¿Qué opción representa mejor X ≥ 11

A.

B.

C. 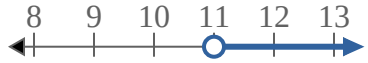

D.

4) ¿Qué opción representa mejor X ≥ -4

A.

B.

C.

D.

5) ¿Qué opción representa mejor X ≥ -1

A.

B.

C. 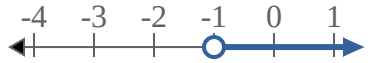

D.

6) ¿Qué opción representa mejor X ≤ -3

A.

B. 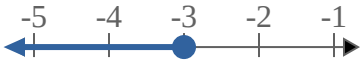

C.

D. 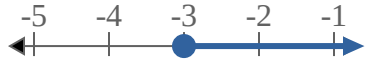

7) ¿Qué opción representa mejor X > -19

A.

B.

C. 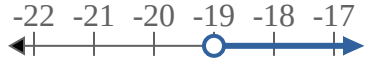

D.

8) ¿Qué opción representa mejor X > 6

A.

B. 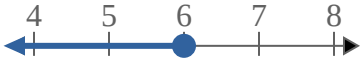

C.

D. 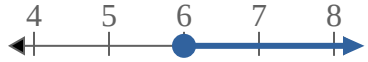

Respuestas

1. **B**
2. **A**
3. **D**
4. **D**
5. **D**
6. **B**
7. **C**
8. **C**

1-8	88	75	63	50	38	25	13	0