Máquinas de Funciones - (Sumar y Restar) Nombre:

Determina la regla que cada máquina de función está usando.

Ej)

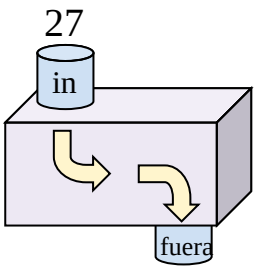

Agregar 12

1)

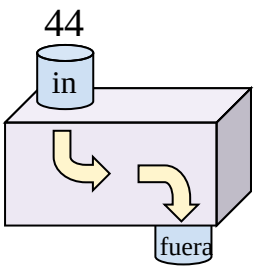

2)

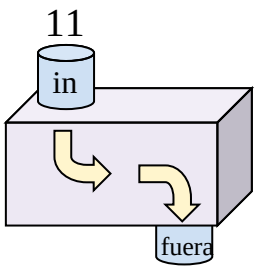

3)

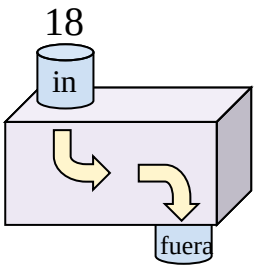

4)

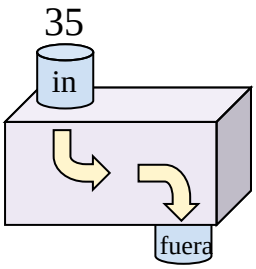

5)

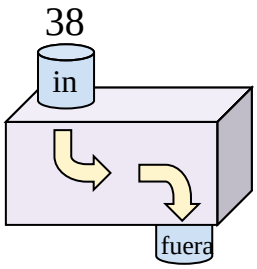

6)

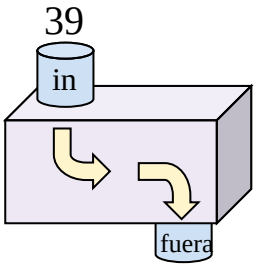

7)

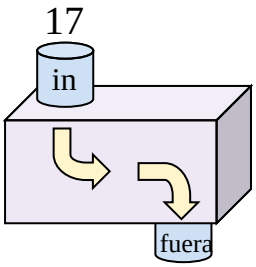

8)

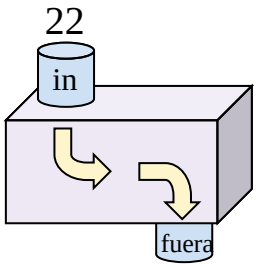

9)

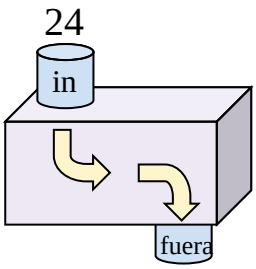

10)

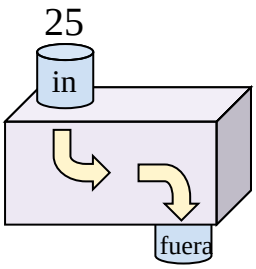

11)

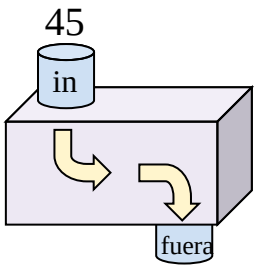

Respuestas

Ej. **Agregar 12**

1. _____
2. _____
3. _____
4. _____
5. _____
6. _____
7. _____
8. _____
9. _____
10. _____
11. _____

1-10	91	82	73	64	55	45	36	27	18	9
11	0									

Determina la regla que cada máquina de función está usando.

Ej)

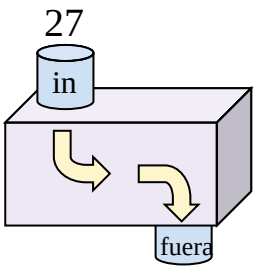

Agregar 12

1)

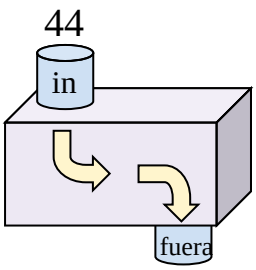

Restar 30

2)

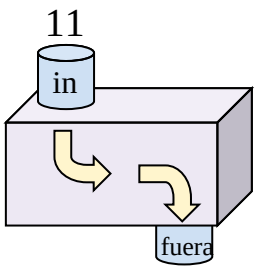

Agregar 8

3)

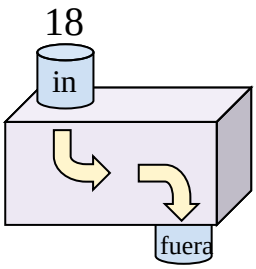

Agregar 30

4)

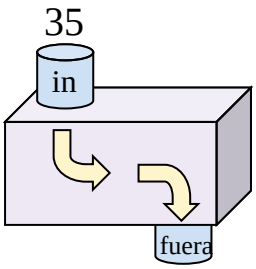

Restar 26

5)

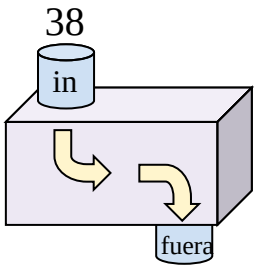

Restar 22

6)

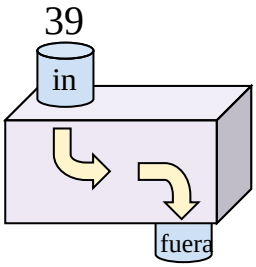

Restar 21

7)

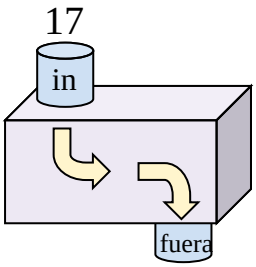

Agregar 18

8)

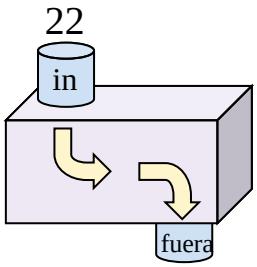

Restar 5

9)

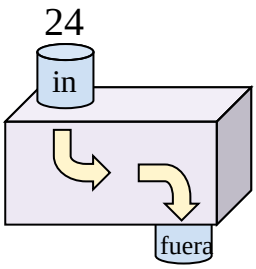

Agregar 12

10)

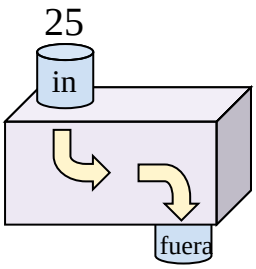

Agregar 18

11)

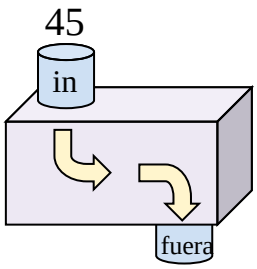

Restar 35

Respuestas

Ej. **Agregar 12**

1. **Restar 30**
2. **Agregar 8**
3. **Agregar 30**
4. **Restar 26**
5. **Restar 22**
6. **Restar 21**
7. **Agregar 18**
8. **Restar 5**
9. **Agregar 12**
10. **Agregar 18**
11. **Restar 35**

1-10	91	82	73	64	55	45	36	27	18	9
11	0									