Determina la regla que cada máquina de función está usando.

Ej)

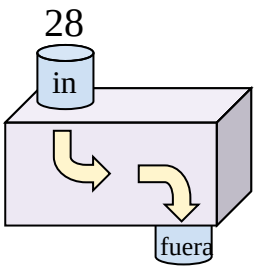

Agregar 8

1)

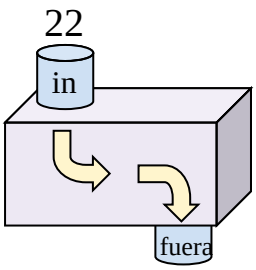

2)

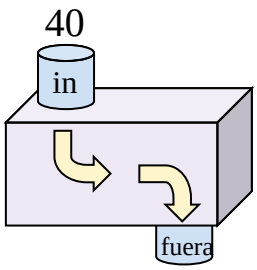

3)

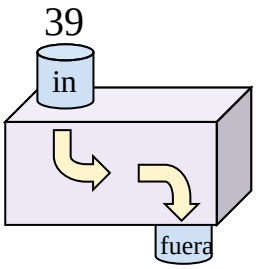

4)

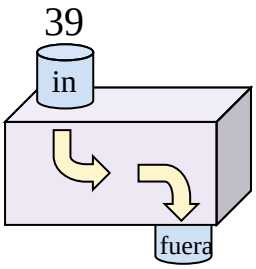

5)

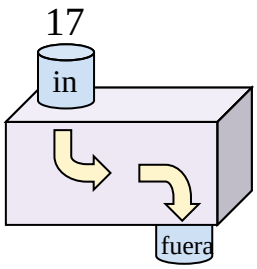

6)

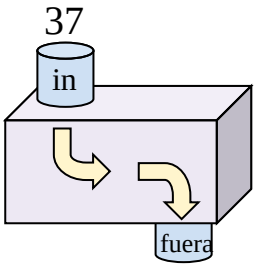

7)

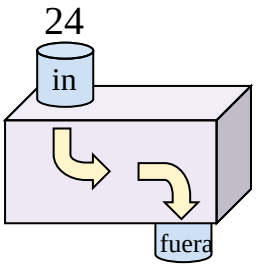

8)

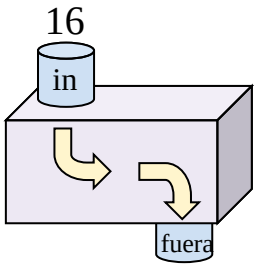

9)

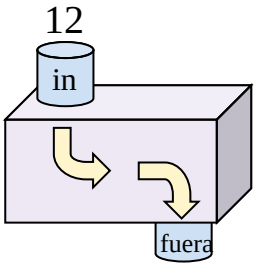

10)

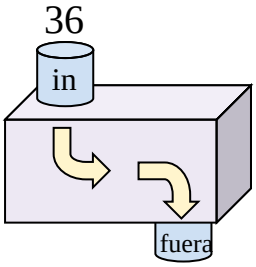

11)

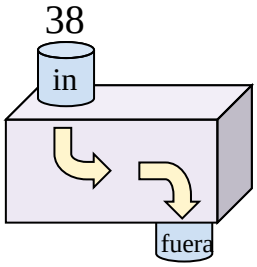

Respuestas

Ej. Agregar 8

1. _____
2. _____
3. _____
4. _____
5. _____
6. _____
7. _____
8. _____
9. _____
10. _____
11. _____

1-10	91	82	73	64	55	45	36	27	18	9
11	0									

Determina la regla que cada máquina de función está usando.

Ej)

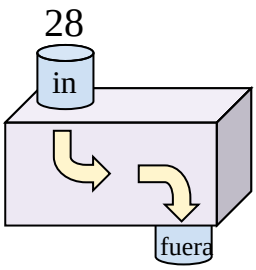

Agregar 8

1)

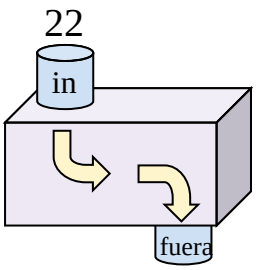

Agregar 6

2)

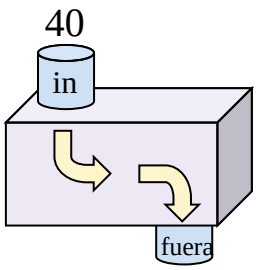

Restar 16

3)

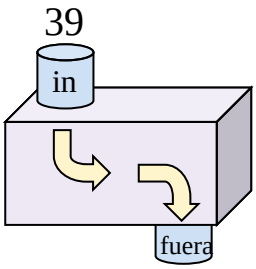

Restar 17

4)

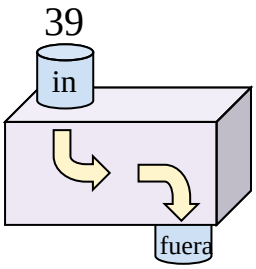

Restar 32

5)

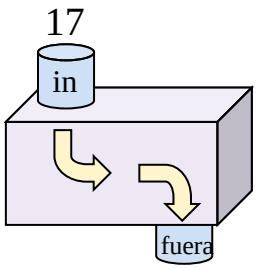

Restar 6

6)

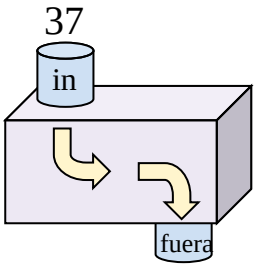

Restar 14

7)

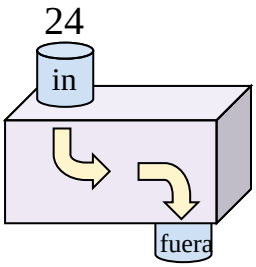

Agregar 18

8)

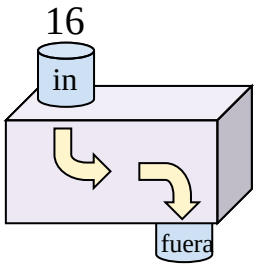

Agregar 33

9)

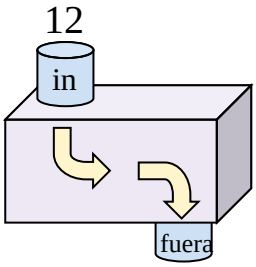

Agregar 34

10)

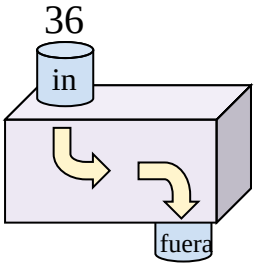

Restar 26

11)

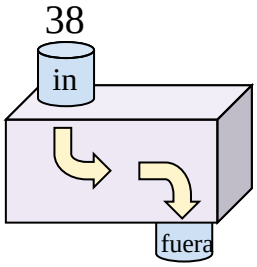

Restar 9

Respuestas

Ej.	Agregar 8
1.	Agregar 6
2.	Restar 16
3.	Restar 17
4.	Restar 32
5.	Restar 6
6.	Restar 14
7.	Agregar 18
8.	Agregar 33
9.	Agregar 34
10.	Restar 26
11.	Restar 9

1-10	91	82	73	64	55	45	36	27	18	9
11	0									