Máquinas de Funciones - (Sumar y Restar) Nombre:

Determina la regla que cada máquina de función está usando.

Ej)

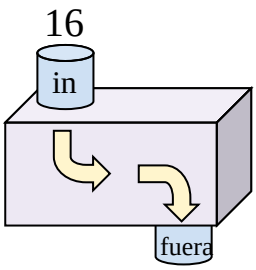

Agregar 12

1)

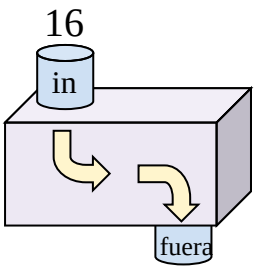

2)

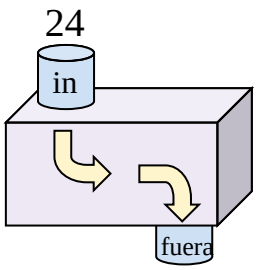

3)

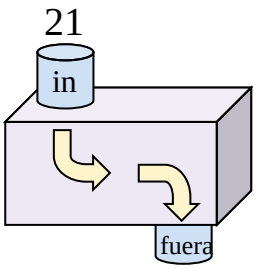

4)

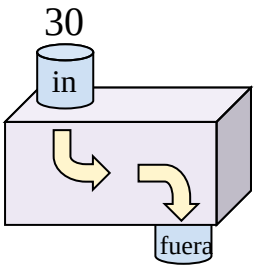

5)

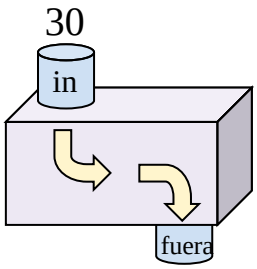

6)

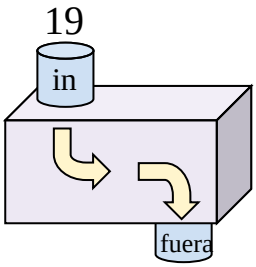

7)

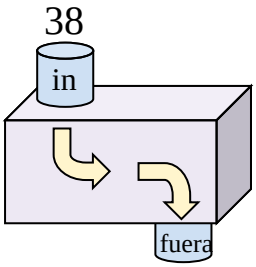

8)

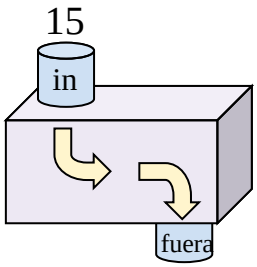

9)

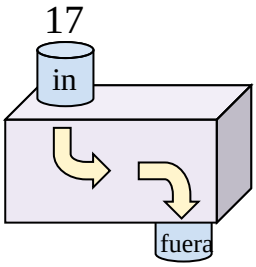

10)

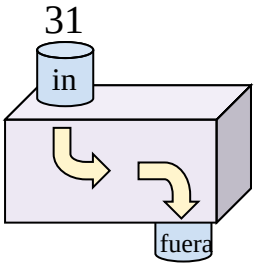

11)

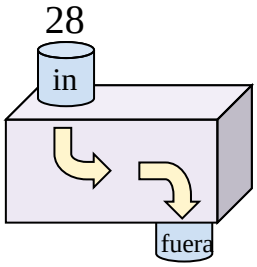

Respuestas

Ej. **Agregar 12**

1. _____
2. _____
3. _____
4. _____
5. _____
6. _____
7. _____
8. _____
9. _____
10. _____
11. _____

1-10	91	82	73	64	55	45	36	27	18	9
11	0									

Determina la regla que cada máquina de función está usando.

Ej)

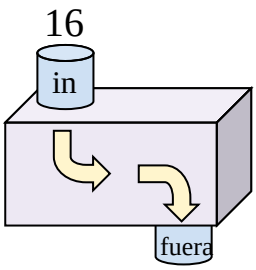

Agregar 12

1)

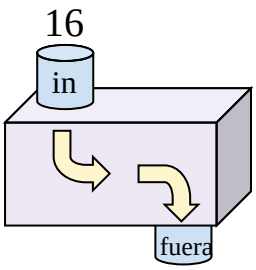

Agregar 6

2)

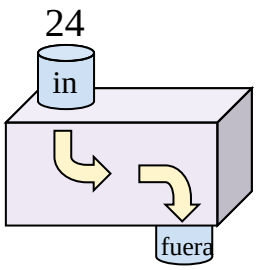

Restar 17

3)

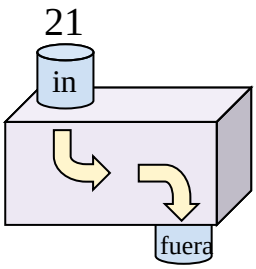

Agregar 14

4)

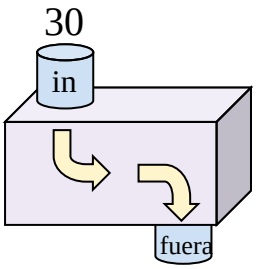

Restar 17

5)

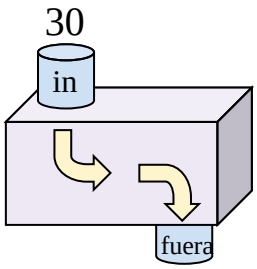

Restar 7

6)

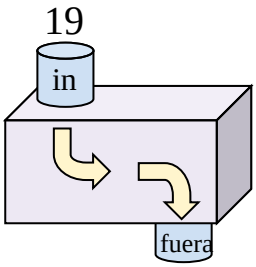

Agregar 13

7)

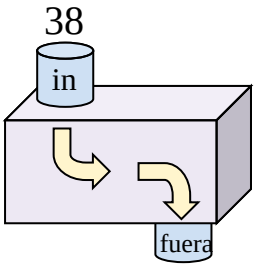

Restar 17

8)

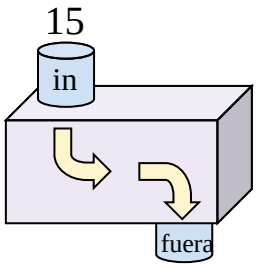

Agregar 8

9)

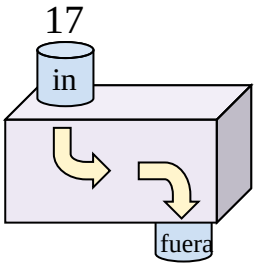

Agregar 15

10)

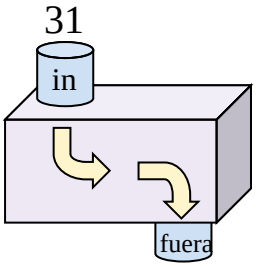

Restar 24

11)

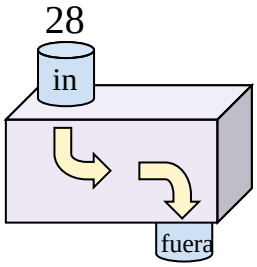

Restar 18

Respuestas

Ej.	Agregar 12
1.	Agregar 6
2.	Restar 17
3.	Agregar 14
4.	Restar 17
5.	Restar 7
6.	Agregar 13
7.	Restar 17
8.	Agregar 8
9.	Agregar 15
10.	Restar 24
11.	Restar 18

1-10	91	82	73	64	55	45	36	27	18	9
11	0									