Máquinas de Funciones - (Sumar y Restar)

Nombre:

Determina la regla que cada máquina de función está usando.

Ej)

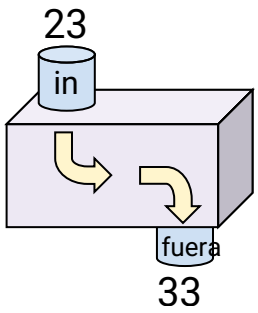

Sumar 10

1)

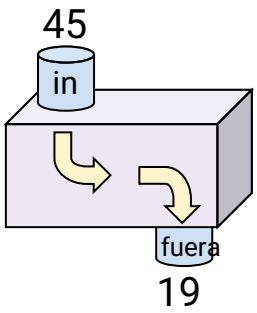

2)

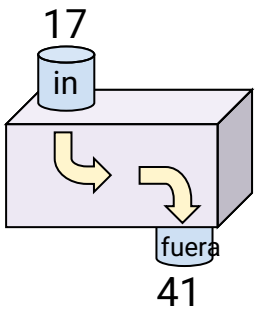

3)

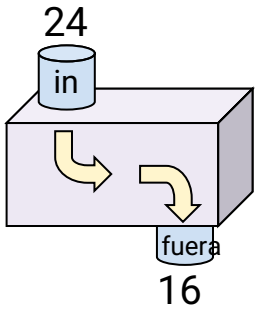

4)

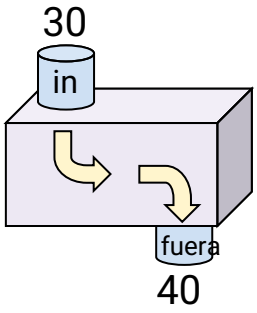

5)

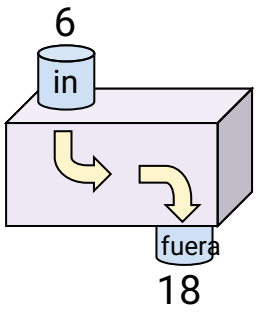

6)

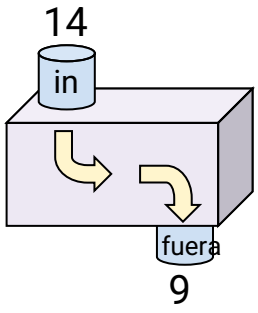

7)

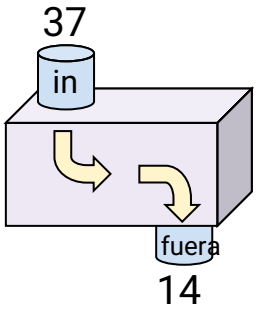

8)

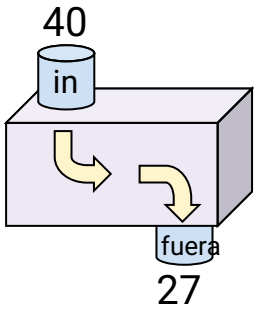

9)

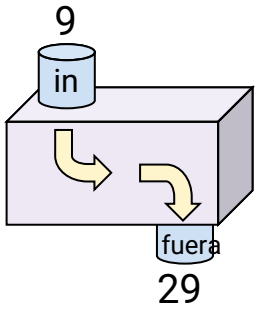

10)

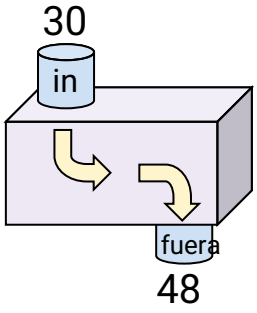

11)

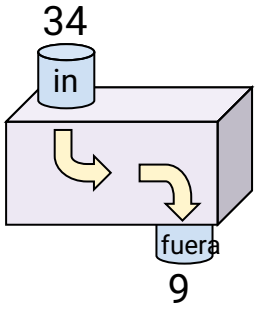

Respuestas

Ej. Sumar 10

1. _____
2. _____
3. _____
4. _____
5. _____
6. _____
7. _____
8. _____
9. _____
10. _____
11. _____

1-10	91	82	73	64	55	45	36	27	18	9
11	0									

Máquinas de Funciones - (Sumar y Restar)

Nombre: **Clave De Respuestas**

Determina la regla que cada máquina de función está usando.

Ej)

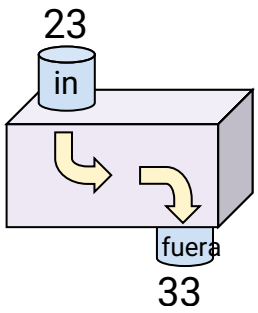

Sumar 10

1)

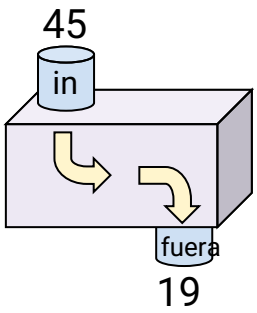

Restar 26

2)

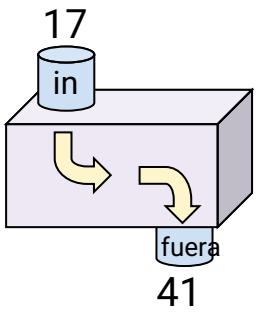

Sumar 24

3)

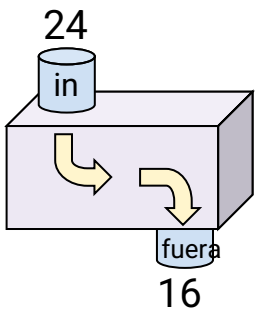

Restar 8

4)

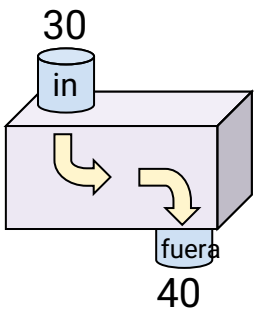

Sumar 10

5)

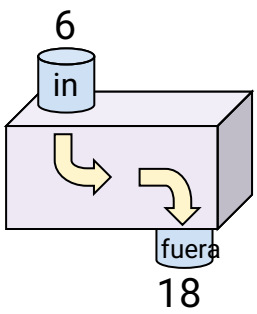

Sumar 12

6)

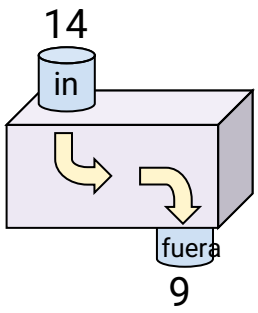

Restar 5

7)

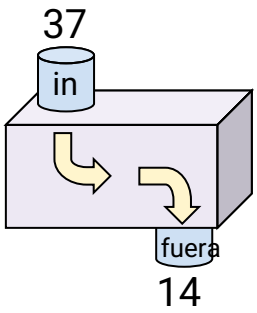

Restar 23

8)

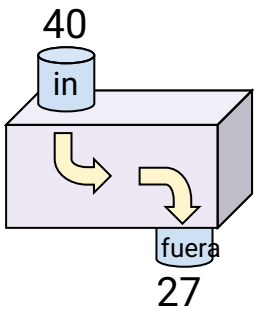

Restar 13

9)

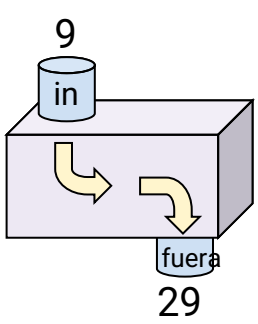

Sumar 20

10)

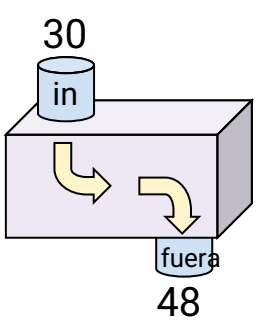

Sumar 18

11)

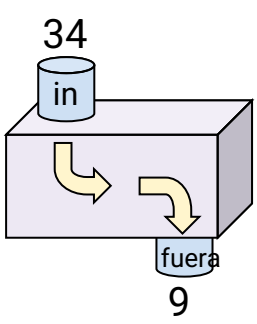

Restar 25

Respuestas

Ej.	Sumar 10
1.	Restar 26
2.	Sumar 24
3.	Restar 8
4.	Sumar 10
5.	Sumar 12
6.	Restar 5
7.	Restar 23
8.	Restar 13
9.	Sumar 20
10.	Sumar 18
11.	Restar 25