Re-escribiendo problemas de multiplicación (Visual)

Nombre:

Escribir cada matriz como un problema de multiplicación y resolver.

Ej)



1)

2)

3)

4)



5)

6)



7)



8)



9)

10)



11)



Respuestas

Ej. 10 × 8 = 80

1. _____
2. _____
3. _____
4. _____
5. _____
6. _____
7. _____
8. _____
9. _____
10. _____
11. _____

Re-escribiendo problemas de multiplicación (Visual)

Nombre: **Clave De Respuestas**

Escribir cada matriz como un problema de multiplicación y resolver.

Ej)



1)

2)

3)

4)



5)

6)



7)



8)



9)

10)



11)



Respuestas

Ej.	10 × 8 = 80
1.	9 × 9 = 81
2.	8 × 3 = 24
3.	10 × 2 = 20
4.	6 × 10 = 60
5.	6 × 9 = 54
6.	7 × 5 = 35
7.	7 × 9 = 63
8.	3 × 7 = 21
9.	8 × 7 = 56
10.	5 × 4 = 20
11.	7 × 10 = 70