Re-escribiendo problemas de multiplicación (Visual)

Nombre:

Escribir cada matriz como un problema de multiplicación y resolver.

Ej)

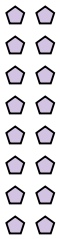

1)

2)



3)



4)



5)

6)

7)



8)

9)

10)



11)



Respuestas

Ej. **8 × 2 = 16**

1. _____
2. _____
3. _____
4. _____
5. _____
6. _____
7. _____
8. _____
9. _____
10. _____
11. _____

Re-escribiendo problemas de multiplicación (Visual)

Nombre: **Clave De Respuestas**

Escribir cada matriz como un problema de multiplicación y resolver.

Ej)

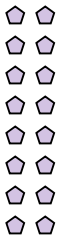

1)

2)



3)



4)



5)

6)

7)



8)

9)

10)



11)



Respuestas

Ej. **8 × 2 = 16**

1. **5 × 4 = 20**
2. **8 × 10 = 80**
3. **8 × 5 = 40**
4. **10 × 7 = 70**
5. **5 × 3 = 15**
6. **7 × 7 = 49**
7. **9 × 8 = 72**
8. **9 × 3 = 27**
9. **2 × 5 = 10**
10. **5 × 8 = 40**
11. **4 × 10 = 40**