Expresando Desigualdades en una Línea de Números

Nombre:

Usa la línea de números para expresar la desigualdad.

Ej) $X \geq -27$

-32 -31 -30 -29 -28 -27 -26 -25 -24 -23 -22 -21 -20

1) $X < 140$

134 135 136 137 138 139 140 141 142 143 144 145 146 147

2) $X \leq 54$

48 49 50 51 52 53 54 55 56 57 58 59

3) $X \leq -190$

-197 -196 -195 -194 -193 -192 -191 -190 -189 -188 -187 -186 -185

4) $X < -120$

-180 -170 -160 -150 -140 -130 -120 -110 -100 -90 -80 -70

5) $X \geq 117$

112 113 114 115 116 117 118 119 120 121 122 123 124

6) $X \leq 50$

-20 -10 0 10 20 30 40 50 60 70 80 90 100 110 120

7) $X \geq -70$

-95 -90 -85 -80 -75 -70 -65 -60 -55 -50 -45

8) $X > 35$

10 15 20 25 30 35 40 45 50 55 60

9) $X > -170$

-240 -230 -220 -210 -200 -190 -180 -170 -160 -150 -140 -130 -120 -110 -100

10) $X > -150$

-200 -190 -180 -170 -160 -150 -140 -130 -120 -110 -100

11) $X > -90$

-96 -95 -94 -93 -92 -91 -90 -89 -88 -87 -86 -85 -84

12) $X \geq 65$

40 45 50 55 60 65 70 75 80 85 90 95 100

13) $X > -5$

-40 -35 -30 -25 -20 -15 -10 -5 0 5 10 15 20 25 30

1-10	92	85	77	69	62	54	46	38	31	23
11-13	15	8	0							

Expresando Desigualdades en una Línea de Números Nombre: **Clave De Respuestas**

Usa la línea de números para expresar la desigualdad.

Ej) $X \geq -27$

1) $X < 140$

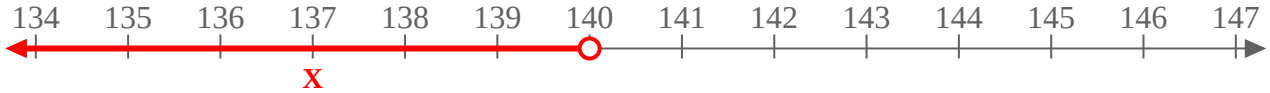

2) $X \leq 54$

3) $X \leq -190$

4) $X < -120$

5) $X \geq 117$

6) $X \leq 50$

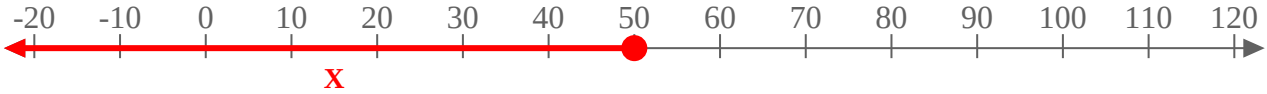

7) $X \geq -70$

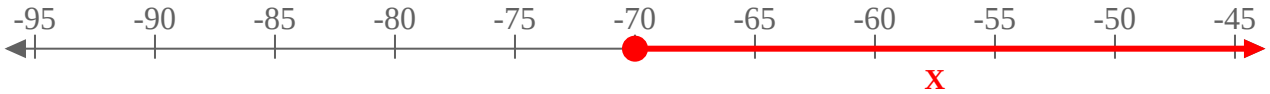

8) $X > 35$

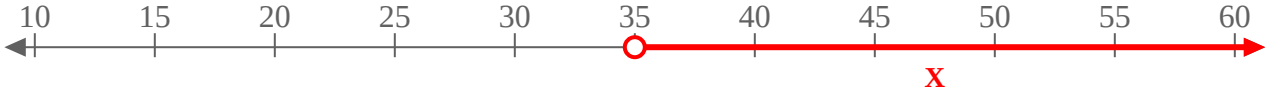

9) $X > -170$

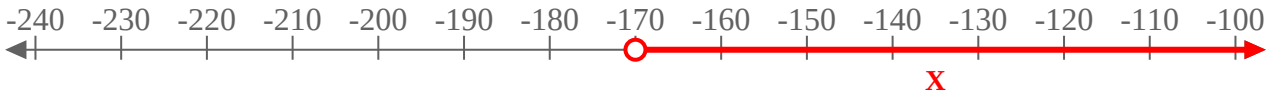

10) $X > -150$

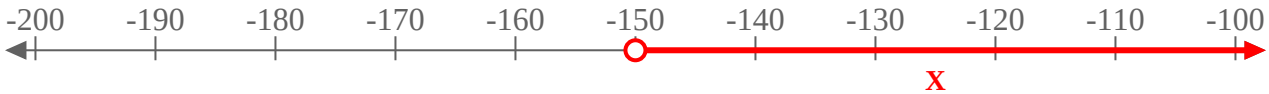

11) $X > -90$

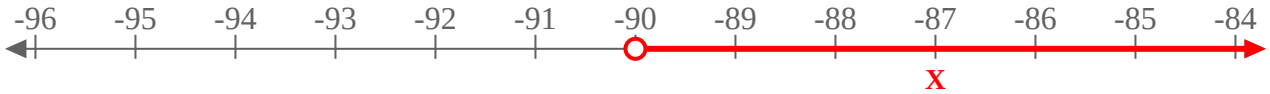

12) $X \geq 65$

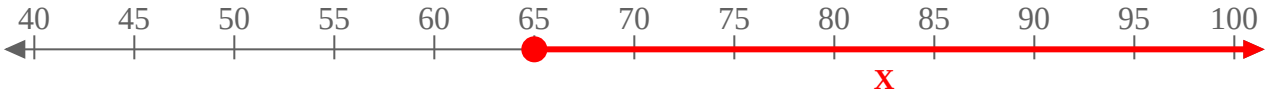

13) $X > -5$

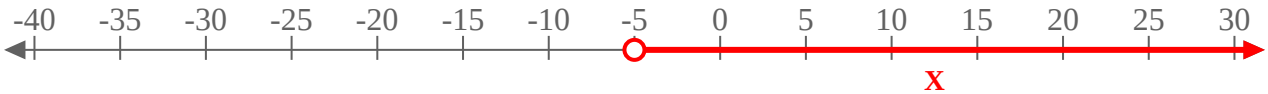

1-10	92	85	77	69	62	54	46	38	31	23
11-13	15	8	0							