Nombrando Fracciones

Nombre:

**Determina cuál letra mejor describe a la porción sombreada.**

**1)**



A. un cuarto
B. tres cuartos
C. una mitad

**2)**

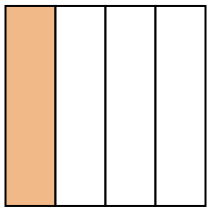

A. una mitad
B. un cuarto
C. dos mitades

**3)**

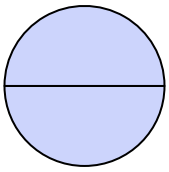

A. una mitad
B. un cuarto
C. dos mitades

**4)**



A. dos mitades
B. tres cuartos
C. una mitad

**5)**

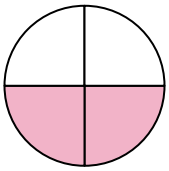

A. dos cuartos
B. tres cuartos
C. dos mitades

**6)**

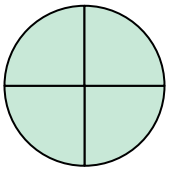

A. dos cuartos
B. tres cuartos
C. una mitad

**7)**

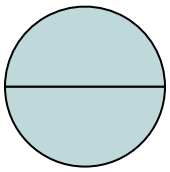

A. un cuarto
B. dos mitades
C. tres cuartos

**8)**

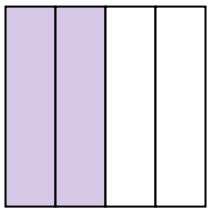

A. cuatro cuartos
B. dos cuartos
C. dos mitades

**9)**

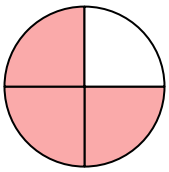

A. dos mitades
B. tres cuartos
C. dos cuartos

**Respuestas**

1. _____
2. _____
3. _____
4. _____
5. _____
6. _____
7. _____
8. _____
9. _____



| 1-9 | 89 | 78 | 67 | 56 | 44 | 33 | 22 | 11 | 0 |
|---|---|---|---|---|---|---|---|---|---|

Nombre: **Clave De Respuestas**

**Determina cuál letra mejor describe a la porción sombreada.**

**1)**



A. un cuarto
B. tres cuartos
C. una mitad

**2)**

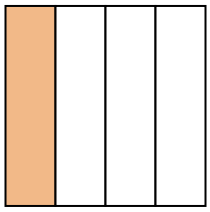

A. una mitad
B. un cuarto
C. dos mitades

**3)**

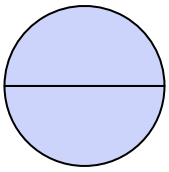

A. una mitad
B. un cuarto
C. dos mitades

**4)**



A. dos mitades
B. tres cuartos
C. una mitad

**5)**

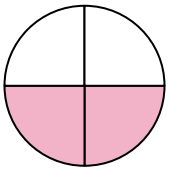

A. dos cuartos
B. tres cuartos
C. dos mitades

**6)**

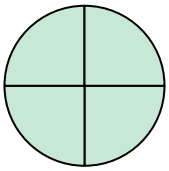

A. dos cuartos
B. tres cuartos
C. una mitad

**7)**

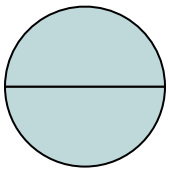

A. un cuarto
B. dos mitades
C. tres cuartos

**8)**

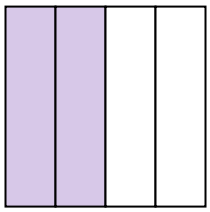

A. cuatro cuartos
B. dos cuartos
C. dos mitades

**9)**

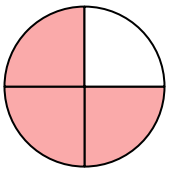

A. dos mitades
B. tres cuartos
C. dos cuartos

**Respuestas**

1. **A**
2. **B**
3. **C**
4. **C**
5. **A**
6. **B**
7. **B**
8. **B**
9. **B**



| 1-9 | 89 | 78 | 67 | 56 | 44 | 33 | 22 | 11 | 0 |
|---|---|---|---|---|---|---|---|---|---|