Multiplicando Fracciones (visualmente)

Nombre:

Usa la caja para mostrar de manera visual cómo multiplicar dos fracciones.

Ej) $\frac{3}{6} \times \frac{1}{9} =$

1) $\frac{2}{3} \times \frac{2}{6} =$

2) $\frac{2}{3} \times \frac{2}{3} =$

3) $\frac{6}{7} \times \frac{1}{3} =$

4) $\frac{1}{7} \times \frac{1}{2} =$

5) $\frac{3}{8} \times \frac{5}{9} =$

6) $\frac{3}{4} \times \frac{1}{7} =$

7) $\frac{2}{8} \times \frac{2}{5} =$

8) $\frac{3}{7} \times \frac{3}{8} =$

9) $\frac{4}{5} \times \frac{1}{4} =$

10) $\frac{2}{4} \times \frac{6}{8} =$

11) $\frac{2}{7} \times \frac{1}{4} =$

Respuestas

Ej. $\frac{3}{54}$

1. _____
2. _____
3. _____
4. _____
5. _____
6. _____
7. _____
8. _____
9. _____
10. _____
11. _____

1-10	91	82	73	64	55	45	36	27	18	9
11	0									

Multiplicando Fracciones (visualmente)

Nombre: **Clave De Respuestas**

Usa la caja para mostrar de manera visual cómo multiplicar dos fracciones.

Ej) $\frac{3}{6} \times \frac{1}{9} =$

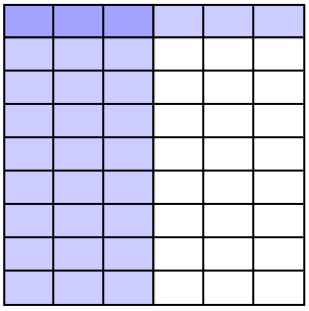

1) $\frac{2}{3} \times \frac{2}{6} =$

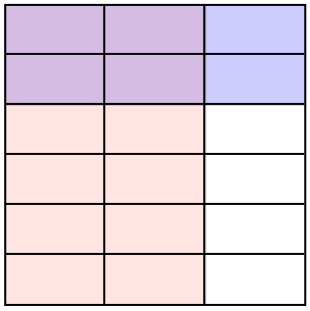

2) $\frac{2}{3} \times \frac{2}{3} =$



3) $\frac{6}{7} \times \frac{1}{3} =$

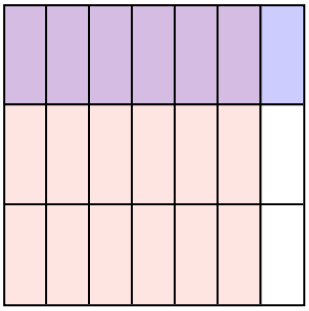

4) $\frac{1}{7} \times \frac{1}{2} =$

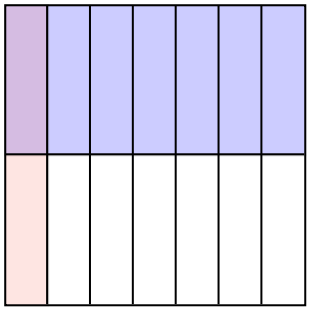

5) $\frac{3}{8} \times \frac{5}{9} =$

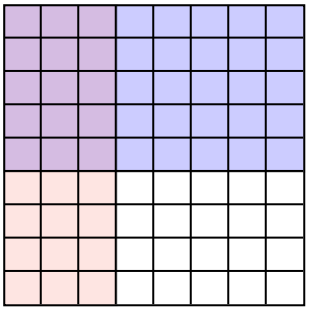

6) $\frac{3}{4} \times \frac{1}{7} =$

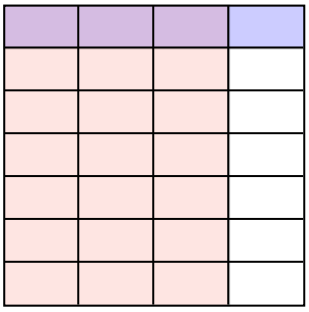

7) $\frac{2}{8} \times \frac{2}{5} =$

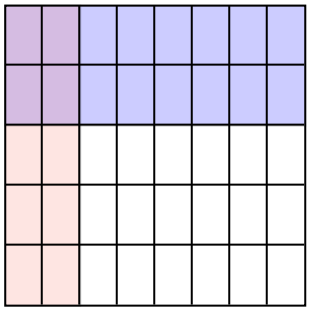

8) $\frac{3}{7} \times \frac{3}{8} =$

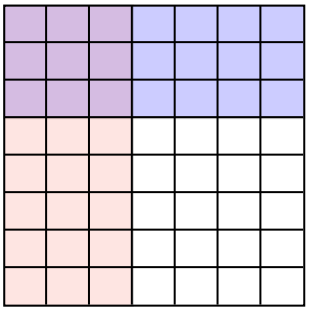

9) $\frac{4}{5} \times \frac{1}{4} =$

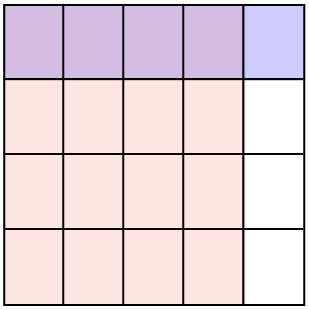

10) $\frac{2}{4} \times \frac{6}{8} =$

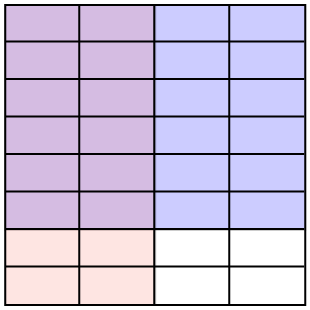

11) $\frac{2}{7} \times \frac{1}{4} =$

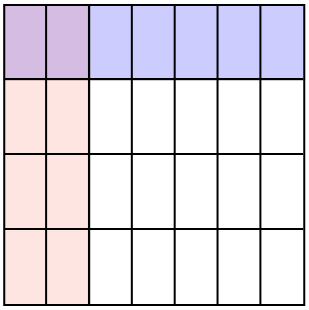

Respuestas

Ej.	3/54
1.	4/18
2.	4/9
3.	6/21
4.	1/14
5.	15/72
6.	3/28
7.	4/40
8.	9/56
9.	4/20
10.	12/32
11.	2/28

1-10	91	82	73	64	55	45	36	27	18	9
11	0									

Multiplicando Fracciones (visualmente) Nombre:

Usa la caja para mostrar de manera visual cómo multiplicar dos fracciones.

Ej) $\frac{1}{2} \times \frac{6}{7} =$

1) $\frac{4}{7} \times \frac{1}{8} =$

2) $\frac{1}{3} \times \frac{2}{3} =$

3) $\frac{2}{6} \times \frac{1}{2} =$

4) $\frac{3}{8} \times \frac{5}{8} =$

5) $\frac{5}{8} \times \frac{6}{7} =$

6) $\frac{3}{4} \times \frac{1}{3} =$

7) $\frac{4}{7} \times \frac{3}{8} =$

8) $\frac{2}{3} \times \frac{2}{8} =$

9) $\frac{1}{2} \times \frac{3}{5} =$

10) $\frac{1}{4} \times \frac{4}{9} =$

11) $\frac{1}{7} \times \frac{5}{9} =$

Respuestas

Ej. $6/14$

1. _____
2. _____
3. _____
4. _____
5. _____
6. _____
7. _____
8. _____
9. _____
10. _____
11. _____

1-10	91	82	73	64	55	45	36	27	18	9
11	0									

Multiplicando Fracciones (visualmente) Nombre: **Clave De Respuestas**

Usa la caja para mostrar de manera visual cómo multiplicar dos fracciones.

Ej) $\frac{1}{2} \times \frac{6}{7} =$



1) $\frac{4}{7} \times \frac{1}{8} =$

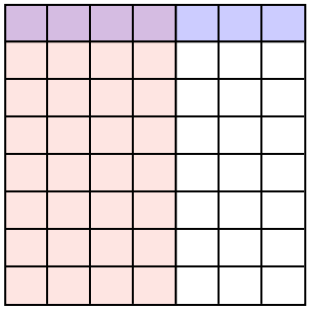

2) $\frac{1}{3} \times \frac{2}{3} =$



3) $\frac{2}{6} \times \frac{1}{2} =$

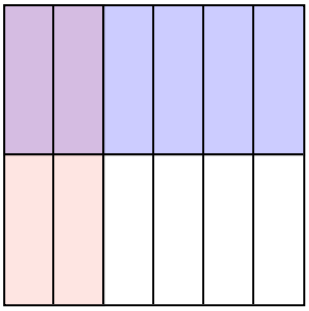

4) $\frac{3}{8} \times \frac{5}{8} =$



5) $\frac{5}{8} \times \frac{6}{7} =$

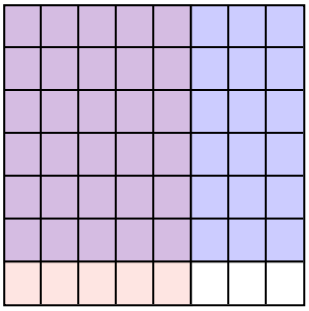

6) $\frac{3}{4} \times \frac{1}{3} =$

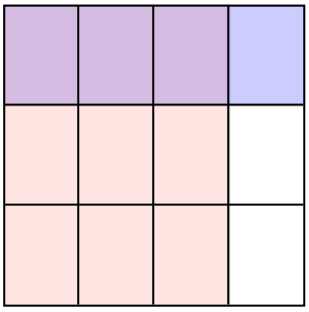

7) $\frac{4}{7} \times \frac{3}{8} =$

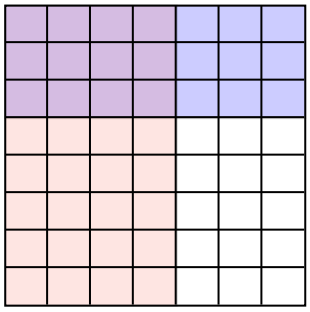

8) $\frac{2}{3} \times \frac{2}{8} =$

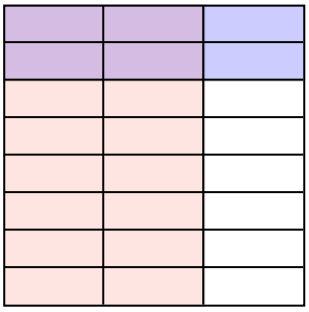

9) $\frac{1}{2} \times \frac{3}{5} =$



10) $\frac{1}{4} \times \frac{4}{9} =$

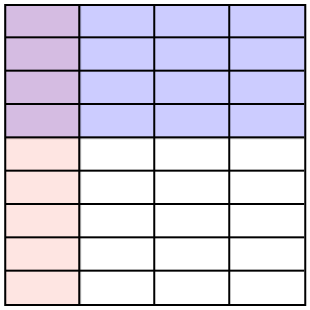

11) $\frac{1}{7} \times \frac{5}{9} =$

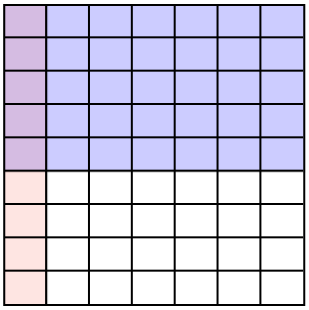

Respuestas

Ej.	6/14
1.	4/56
2.	2/9
3.	2/12
4.	15/64
5.	30/56
6.	3/12
7.	12/56
8.	4/24
9.	3/10
10.	4/36
11.	5/63

1-10	91	82	73	64	55	45	36	27	18	9
11	0									

Multiplicando Fracciones (visualmente) Nombre:

Usa la caja para mostrar de manera visual cómo multiplicar dos fracciones.

Ej) $\frac{8}{9} \times \frac{5}{8} =$

1) $\frac{1}{3} \times \frac{3}{4} =$

2) $\frac{3}{4} \times \frac{2}{9} =$

3) $\frac{1}{2} \times \frac{1}{2} =$

4) $\frac{1}{4} \times \frac{1}{2} =$

5) $\frac{1}{9} \times \frac{2}{4} =$

6) $\frac{5}{6} \times \frac{1}{6} =$

7) $\frac{6}{9} \times \frac{2}{3} =$

8) $\frac{5}{6} \times \frac{7}{9} =$

9) $\frac{2}{4} \times \frac{2}{6} =$

10) $\frac{1}{2} \times \frac{1}{6} =$

11) $\frac{5}{7} \times \frac{4}{6} =$

Respuestas

Ej. 40/72

1. _____
2. _____
3. _____
4. _____
5. _____
6. _____
7. _____
8. _____
9. _____
10. _____
11. _____

1-10	91	82	73	64	55	45	36	27	18	9
11	0									

Usa la caja para mostrar de manera visual cómo multiplicar dos fracciones.

Ej) $\frac{8}{9} \times \frac{5}{8} =$

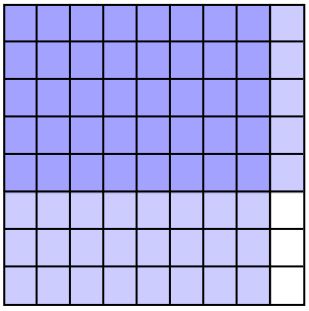

1) $\frac{1}{3} \times \frac{3}{4} =$



2) $\frac{3}{4} \times \frac{2}{9} =$

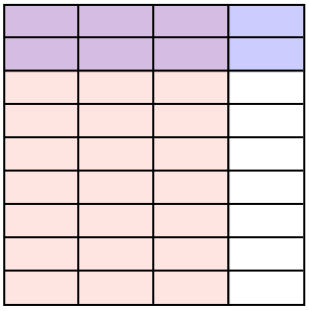

3) $\frac{1}{2} \times \frac{1}{2} =$



4) $\frac{1}{4} \times \frac{1}{2} =$



5) $\frac{1}{9} \times \frac{2}{4} =$

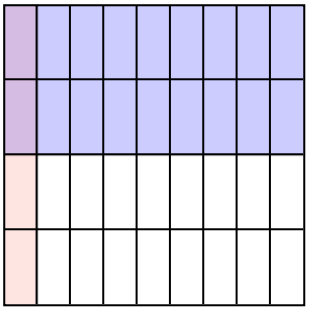

6) $\frac{5}{6} \times \frac{1}{6} =$

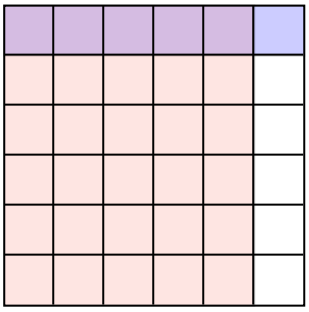

7) $\frac{6}{9} \times \frac{2}{3} =$

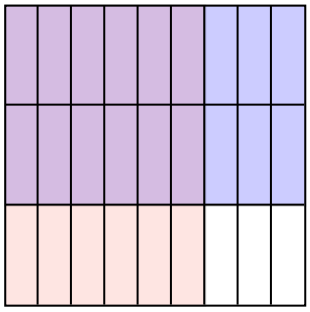

8) $\frac{5}{6} \times \frac{7}{9} =$

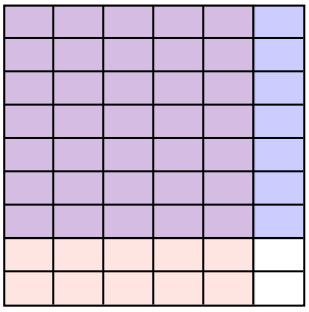

9) $\frac{2}{4} \times \frac{2}{6} =$



10) $\frac{1}{2} \times \frac{1}{6} =$



11) $\frac{5}{7} \times \frac{4}{6} =$

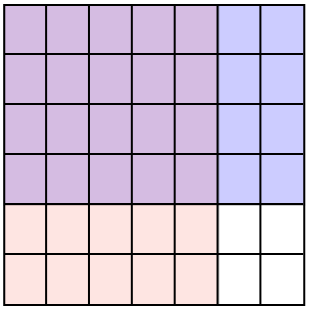

Respuestas

Ej.	40/72
1.	3/12
2.	6/36
3.	1/4
4.	1/8
5.	2/36
6.	5/36
7.	12/27
8.	35/54
9.	4/24
10.	1/12
11.	20/42

1-10	91	82	73	64	55	45	36	27	18	9
11	0									

Multiplicando Fracciones (visualmente)

Nombre:

Usa la caja para mostrar de manera visual cómo multiplicar dos fracciones.

Ej) $\frac{2}{5} \times \frac{3}{8} =$

1) $\frac{2}{3} \times \frac{3}{5} =$

2) $\frac{2}{6} \times \frac{7}{8} =$

3) $\frac{5}{8} \times \frac{1}{4} =$

4) $\frac{1}{4} \times \frac{6}{8} =$

5) $\frac{2}{8} \times \frac{7}{8} =$

6) $\frac{1}{2} \times \frac{1}{3} =$

7) $\frac{1}{2} \times \frac{4}{7} =$

8) $\frac{3}{9} \times \frac{3}{4} =$

9) $\frac{2}{9} \times \frac{3}{4} =$

10) $\frac{4}{6} \times \frac{1}{6} =$

11) $\frac{2}{3} \times \frac{7}{8} =$

Respuestas

Ej. $\frac{6}{40}$

1. _____
2. _____
3. _____
4. _____
5. _____
6. _____
7. _____
8. _____
9. _____
10. _____
11. _____

1-10	91	82	73	64	55	45	36	27	18	9
11	0									

Usa la caja para mostrar de manera visual cómo multiplicar dos fracciones.

Ej) $\frac{2}{5} \times \frac{3}{8} =$

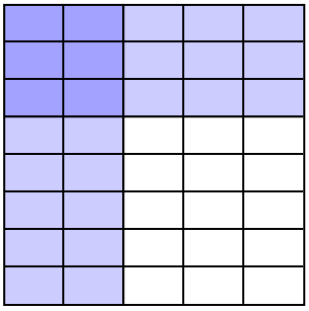

1) $\frac{2}{3} \times \frac{3}{5} =$



2) $\frac{2}{6} \times \frac{7}{8} =$

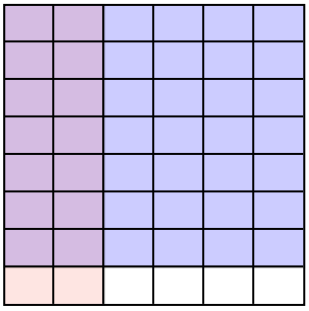

3) $\frac{5}{8} \times \frac{1}{4} =$

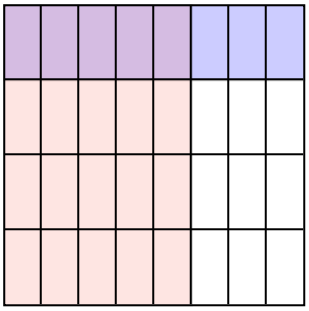

4) $\frac{1}{4} \times \frac{6}{8} =$

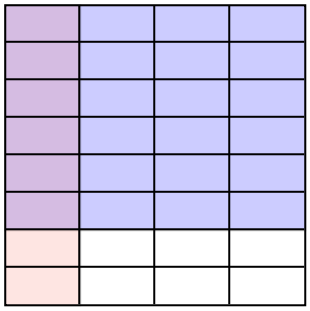

5) $\frac{2}{8} \times \frac{7}{8} =$

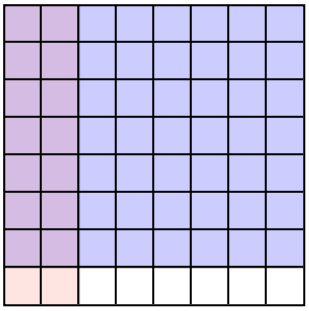

6) $\frac{1}{2} \times \frac{1}{3} =$



7) $\frac{1}{2} \times \frac{4}{7} =$

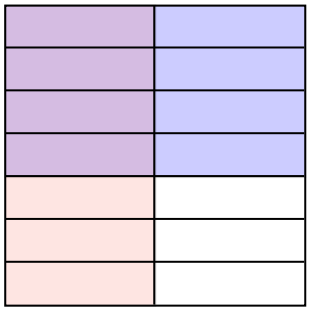

8) $\frac{3}{9} \times \frac{3}{4} =$

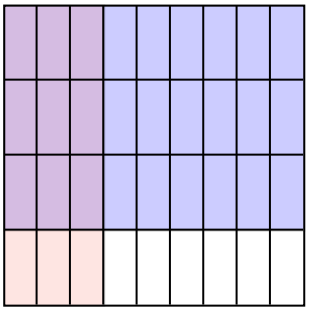

9) $\frac{2}{9} \times \frac{3}{4} =$

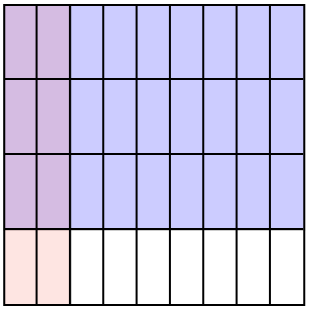

10) $\frac{4}{6} \times \frac{1}{6} =$

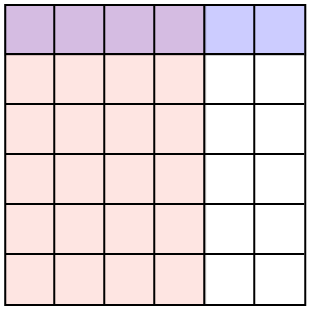

11) $\frac{2}{3} \times \frac{7}{8} =$

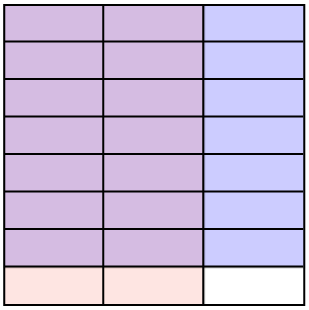

Respuestas

Ej.	6/40
1.	6/15
2.	14/48
3.	5/32
4.	6/32
5.	14/64
6.	1/6
7.	4/14
8.	9/36
9.	6/36
10.	4/36
11.	14/24

1-10	91	82	73	64	55	45	36	27	18	9
11	0									

Multiplicando Fracciones (visualmente) Nombre:

Usa la caja para mostrar de manera visual cómo multiplicar dos fracciones.

Ej) $\frac{1}{2} \times \frac{5}{9} =$

1) $\frac{1}{5} \times \frac{1}{2} =$

2) $\frac{6}{7} \times \frac{4}{7} =$

3) $\frac{1}{6} \times \frac{1}{5} =$

4) $\frac{1}{3} \times \frac{2}{5} =$

5) $\frac{1}{2} \times \frac{1}{2} =$

6) $\frac{3}{5} \times \frac{2}{3} =$

7) $\frac{7}{9} \times \frac{2}{7} =$

8) $\frac{6}{9} \times \frac{4}{9} =$

9) $\frac{5}{8} \times \frac{3}{5} =$

10) $\frac{1}{2} \times \frac{3}{5} =$

11) $\frac{2}{8} \times \frac{1}{2} =$

Respuestas

Ej. $5/18$

1. _____
2. _____
3. _____
4. _____
5. _____
6. _____
7. _____
8. _____
9. _____
10. _____
11. _____

1-10	91	82	73	64	55	45	36	27	18	9
11	0									

Usa la caja para mostrar de manera visual cómo multiplicar dos fracciones.

Ej) $\frac{1}{2} \times \frac{5}{9} =$

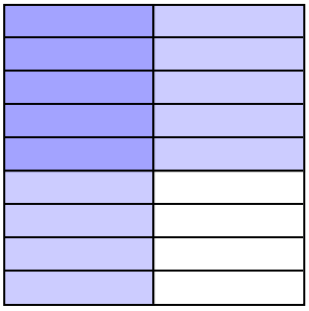

1) $\frac{1}{5} \times \frac{1}{2} =$

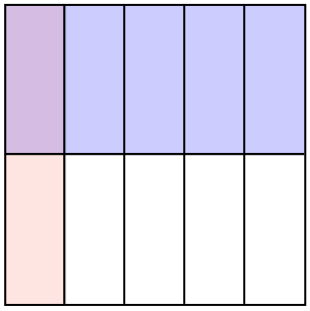

2) $\frac{6}{7} \times \frac{4}{7} =$

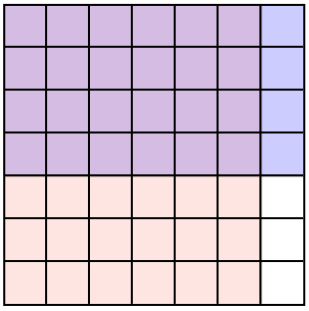

3) $\frac{1}{6} \times \frac{1}{5} =$

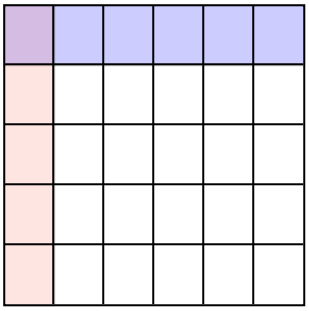

4) $\frac{1}{3} \times \frac{2}{5} =$

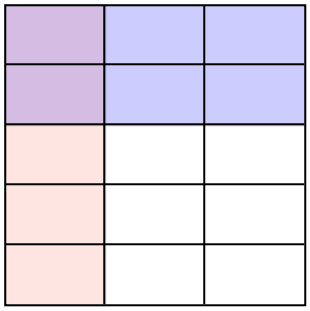

5) $\frac{1}{2} \times \frac{1}{2} =$



6) $\frac{3}{5} \times \frac{2}{3} =$

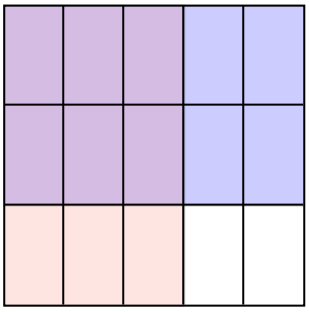

7) $\frac{7}{9} \times \frac{2}{7} =$

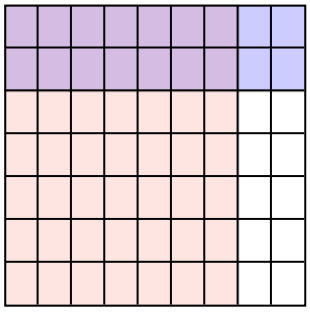

8) $\frac{6}{9} \times \frac{4}{9} =$

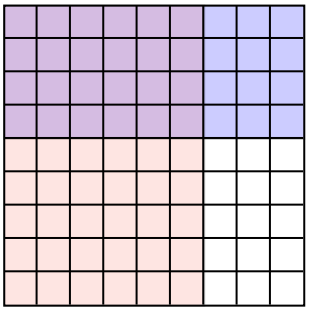

9) $\frac{5}{8} \times \frac{3}{5} =$

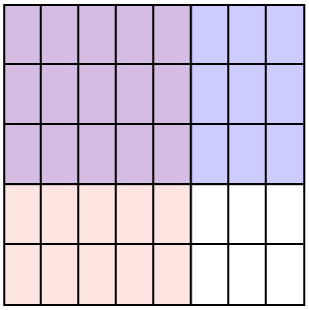

10) $\frac{1}{2} \times \frac{3}{5} =$



11) $\frac{2}{8} \times \frac{1}{2} =$

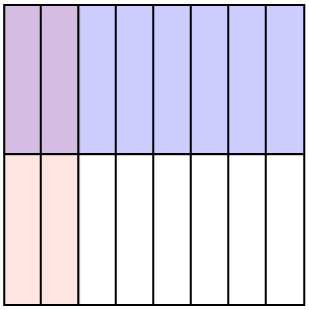

Respuestas

Ej.	5/18
1.	1/10
2.	24/49
3.	1/30
4.	2/15
5.	1/4
6.	6/15
7.	14/63
8.	24/81
9.	15/40
10.	3/10
11.	2/16

1-10	91	82	73	64	55	45	36	27	18	9
11	0									

Multiplicando Fracciones (visualmente) Nombre:

Usa la caja para mostrar de manera visual cómo multiplicar dos fracciones.

Ej) $\frac{2}{4} \times \frac{1}{3} =$

1) $\frac{1}{2} \times \frac{3}{7} =$

2) $\frac{5}{9} \times \frac{3}{6} =$

3) $\frac{1}{3} \times \frac{1}{4} =$

4) $\frac{4}{7} \times \frac{2}{8} =$

5) $\frac{1}{2} \times \frac{2}{4} =$

6) $\frac{7}{8} \times \frac{4}{7} =$

7) $\frac{2}{9} \times \frac{1}{4} =$

8) $\frac{3}{4} \times \frac{5}{8} =$

9) $\frac{2}{7} \times \frac{1}{2} =$

10) $\frac{1}{5} \times \frac{2}{5} =$

11) $\frac{2}{9} \times \frac{2}{5} =$

Respuestas

Ej. $2/12$

1. _____
2. _____
3. _____
4. _____
5. _____
6. _____
7. _____
8. _____
9. _____
10. _____
11. _____

1-10	91	82	73	64	55	45	36	27	18	9
11	0									

Usa la caja para mostrar de manera visual cómo multiplicar dos fracciones.

Ej) $\frac{2}{4} \times \frac{1}{3} =$



1) $\frac{1}{2} \times \frac{3}{7} =$

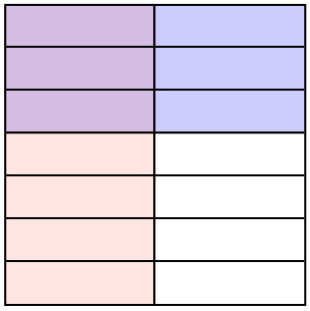

2) $\frac{5}{9} \times \frac{3}{6} =$

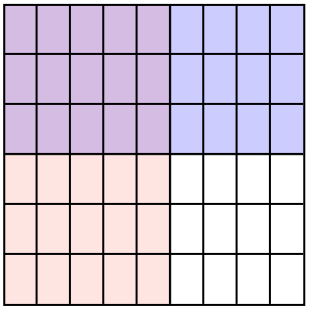

3) $\frac{1}{3} \times \frac{1}{4} =$



4) $\frac{4}{7} \times \frac{2}{8} =$

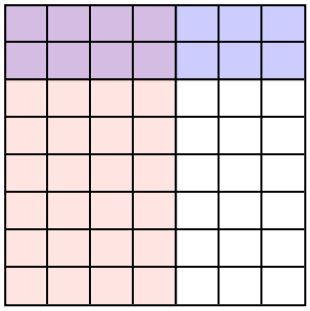

5) $\frac{1}{2} \times \frac{2}{4} =$



6) $\frac{7}{8} \times \frac{4}{7} =$

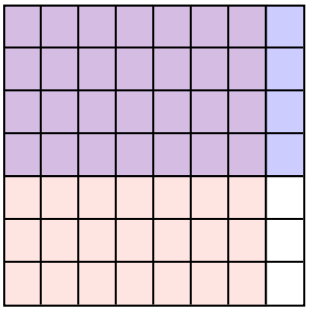

7) $\frac{2}{9} \times \frac{1}{4} =$

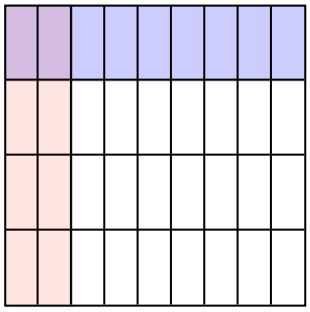

8) $\frac{3}{4} \times \frac{5}{8} =$

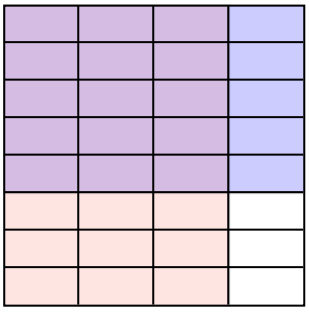

9) $\frac{2}{7} \times \frac{1}{2} =$

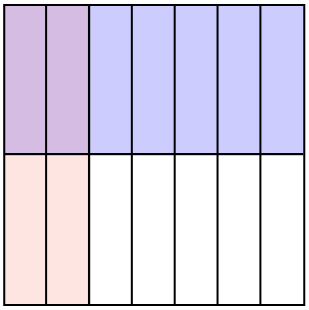

10) $\frac{1}{5} \times \frac{2}{5} =$

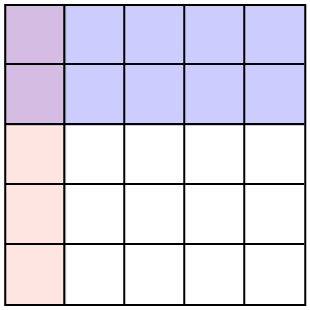

11) $\frac{2}{9} \times \frac{2}{5} =$

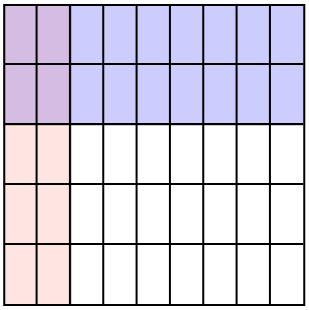

Respuestas

Ej. $\frac{2}{12}$

1. $\frac{3}{14}$
2. $\frac{15}{54}$
3. $\frac{1}{12}$
4. $\frac{8}{56}$
5. $\frac{2}{8}$
6. $\frac{28}{56}$
7. $\frac{2}{36}$
8. $\frac{15}{32}$
9. $\frac{2}{14}$
10. $\frac{2}{25}$
11. $\frac{4}{45}$

1-10	91	82	73	64	55	45	36	27	18	9
11	0									

Multiplicando Fracciones (visualmente) Nombre:

Usa la caja para mostrar de manera visual cómo multiplicar dos fracciones.

Ej) $\frac{3}{5} \times \frac{2}{3} =$

1) $\frac{4}{8} \times \frac{2}{3} =$

2) $\frac{5}{6} \times \frac{1}{3} =$

3) $\frac{2}{5} \times \frac{3}{8} =$

4) $\frac{3}{5} \times \frac{8}{9} =$

5) $\frac{1}{3} \times \frac{1}{2} =$

6) $\frac{3}{4} \times \frac{8}{9} =$

7) $\frac{1}{2} \times \frac{3}{6} =$

8) $\frac{4}{6} \times \frac{4}{6} =$

9) $\frac{2}{7} \times \frac{5}{6} =$

10) $\frac{4}{8} \times \frac{5}{8} =$

11) $\frac{1}{2} \times \frac{1}{3} =$

Respuestas

Ej. $\frac{6}{15}$

1. _____
2. _____
3. _____
4. _____
5. _____
6. _____
7. _____
8. _____
9. _____
10. _____
11. _____

1-10	91	82	73	64	55	45	36	27	18	9
11	0									

Multiplicando Fracciones (visualmente) Nombre: **Clave De Respuestas**

Usa la caja para mostrar de manera visual cómo multiplicar dos fracciones.

Ej) $\frac{3}{5} \times \frac{2}{3} =$

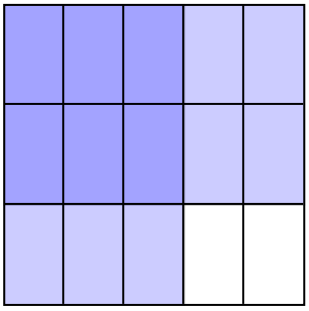

1) $\frac{4}{8} \times \frac{2}{3} =$

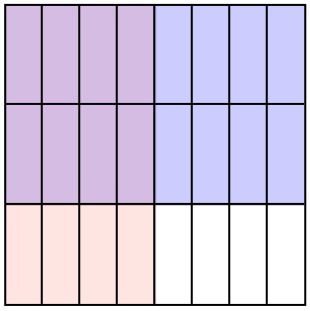

2) $\frac{5}{6} \times \frac{1}{3} =$

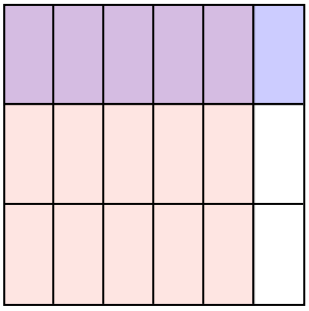

3) $\frac{2}{5} \times \frac{3}{8} =$

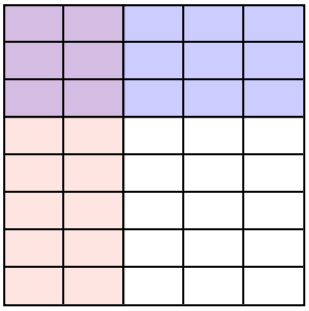

4) $\frac{3}{5} \times \frac{8}{9} =$

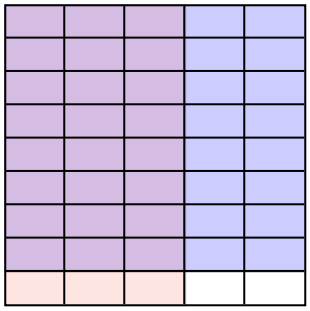

5) $\frac{1}{3} \times \frac{1}{2} =$



6) $\frac{3}{4} \times \frac{8}{9} =$

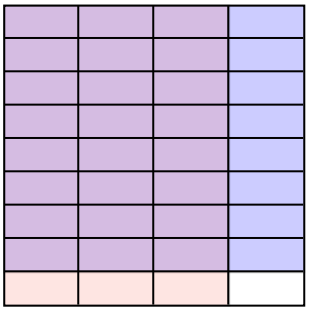

7) $\frac{1}{2} \times \frac{3}{6} =$

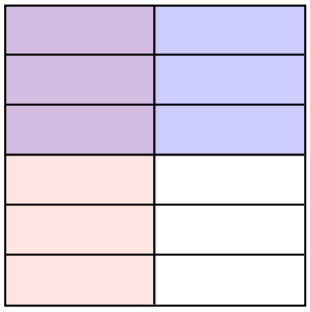

8) $\frac{4}{6} \times \frac{4}{6} =$

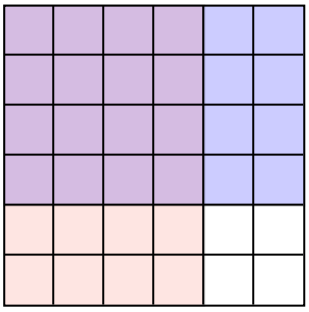

9) $\frac{2}{7} \times \frac{5}{6} =$

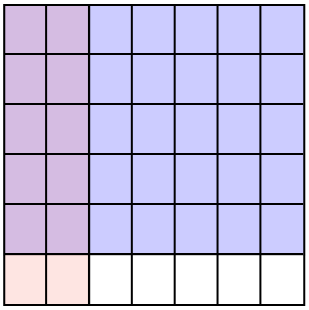

10) $\frac{4}{8} \times \frac{5}{8} =$



11) $\frac{1}{2} \times \frac{1}{3} =$



Respuestas

Ej.	6/15
1.	8/24
2.	5/18
3.	6/40
4.	24/45
5.	1/6
6.	24/36
7.	3/12
8.	16/36
9.	10/42
10.	20/64
11.	1/6

1-10	91	82	73	64	55	45	36	27	18	9
11	0									

Multiplicando Fracciones (visualmente) Nombre:

Usa la caja para mostrar de manera visual cómo multiplicar dos fracciones.

Ej) $\frac{3}{4} \times \frac{1}{7} =$

1) $\frac{3}{5} \times \frac{3}{4} =$

2) $\frac{3}{4} \times \frac{1}{2} =$

3) $\frac{1}{2} \times \frac{6}{8} =$

4) $\frac{3}{4} \times \frac{3}{4} =$

5) $\frac{8}{9} \times \frac{3}{6} =$

6) $\frac{4}{9} \times \frac{1}{6} =$

7) $\frac{4}{6} \times \frac{1}{4} =$

8) $\frac{1}{2} \times \frac{2}{3} =$

9) $\frac{7}{9} \times \frac{3}{8} =$

10) $\frac{3}{5} \times \frac{4}{7} =$

11) $\frac{2}{4} \times \frac{3}{5} =$

Respuestas

Ej. $3/28$

1. _____
2. _____
3. _____
4. _____
5. _____
6. _____
7. _____
8. _____
9. _____
10. _____
11. _____

1-10	91	82	73	64	55	45	36	27	18	9
11	0									

Usa la caja para mostrar de manera visual cómo multiplicar dos fracciones.

Ej) $\frac{3}{4} \times \frac{1}{7} =$

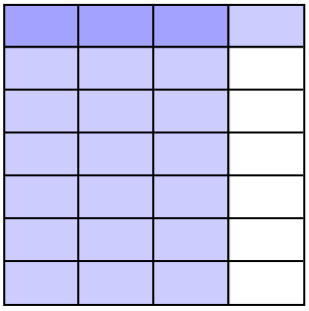

1) $\frac{3}{5} \times \frac{3}{4} =$

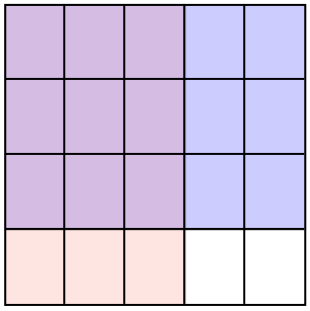

2) $\frac{3}{4} \times \frac{1}{2} =$



3) $\frac{1}{2} \times \frac{6}{8} =$

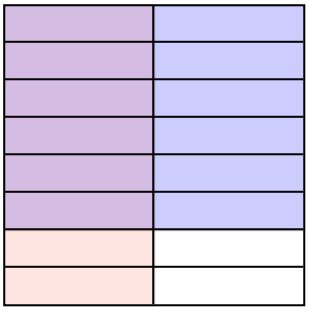

4) $\frac{3}{4} \times \frac{3}{4} =$



5) $\frac{8}{9} \times \frac{3}{6} =$

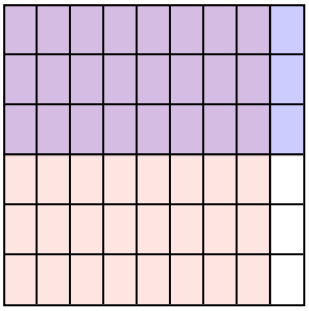

6) $\frac{4}{9} \times \frac{1}{6} =$

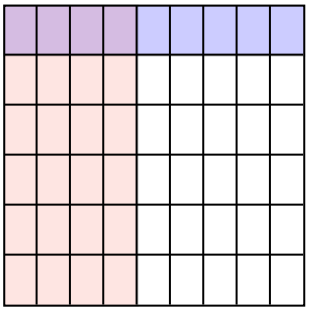

7) $\frac{4}{6} \times \frac{1}{4} =$

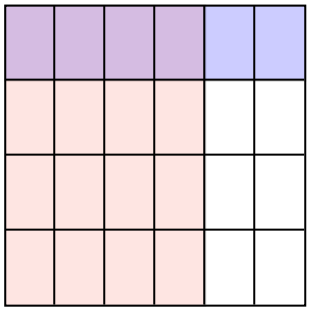

8) $\frac{1}{2} \times \frac{2}{3} =$



9) $\frac{7}{9} \times \frac{3}{8} =$

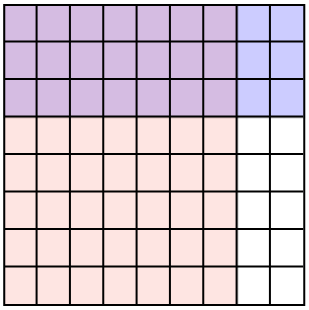

10) $\frac{3}{5} \times \frac{4}{7} =$

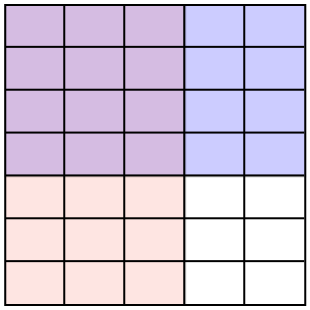

11) $\frac{2}{4} \times \frac{3}{5} =$



Respuestas

Ej.	3/28
1.	9/20
2.	3/8
3.	6/16
4.	9/16
5.	24/54
6.	4/54
7.	4/24
8.	2/6
9.	21/72
10.	12/35
11.	6/20

1-10	91	82	73	64	55	45	36	27	18	9
11	0									

Multiplicando Fracciones (visualmente) Nombre:

Usa la caja para mostrar de manera visual cómo multiplicar dos fracciones.

Ej) $\frac{2}{8} \times \frac{2}{9} =$

1) $\frac{4}{7} \times \frac{1}{5} =$

2) $\frac{4}{6} \times \frac{1}{2} =$

3) $\frac{3}{4} \times \frac{1}{6} =$

4) $\frac{3}{9} \times \frac{4}{5} =$

5) $\frac{3}{6} \times \frac{5}{7} =$

6) $\frac{1}{3} \times \frac{2}{3} =$

7) $\frac{3}{5} \times \frac{5}{9} =$

8) $\frac{3}{7} \times \frac{7}{8} =$

9) $\frac{2}{5} \times \frac{3}{7} =$

10) $\frac{1}{2} \times \frac{6}{8} =$

11) $\frac{3}{5} \times \frac{2}{4} =$

Respuestas

Ej. $\frac{4}{72}$

1. _____
2. _____
3. _____
4. _____
5. _____
6. _____
7. _____
8. _____
9. _____
10. _____
11. _____

1-10	91	82	73	64	55	45	36	27	18	9
11	0									

Multiplicando Fracciones (visualmente) Nombre: **Clave De Respuestas**

Usa la caja para mostrar de manera visual cómo multiplicar dos fracciones.

Ej) $\frac{2}{8} \times \frac{2}{9} =$

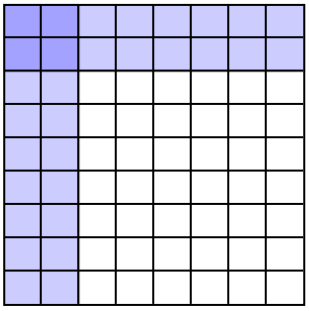

1) $\frac{4}{7} \times \frac{1}{5} =$

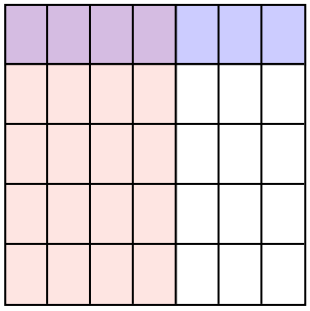

2) $\frac{4}{6} \times \frac{1}{2} =$

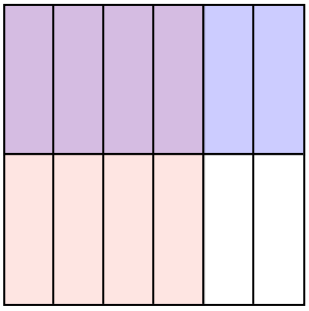

3) $\frac{3}{4} \times \frac{1}{6} =$

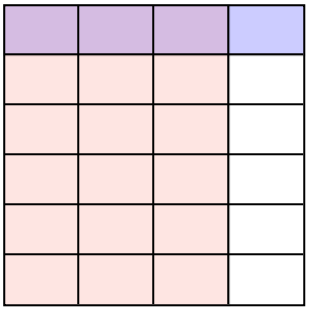

4) $\frac{3}{9} \times \frac{4}{5} =$

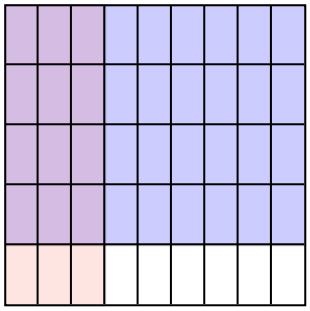

5) $\frac{3}{6} \times \frac{5}{7} =$

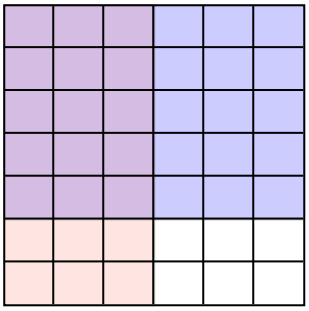

6) $\frac{1}{3} \times \frac{2}{3} =$

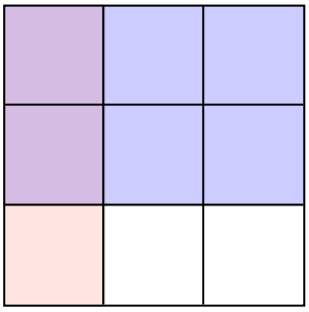

7) $\frac{3}{5} \times \frac{5}{9} =$

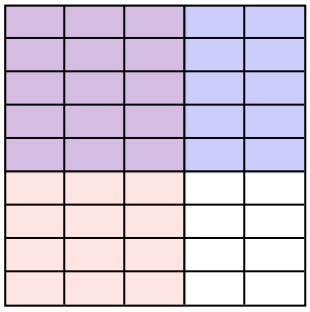

8) $\frac{3}{7} \times \frac{7}{8} =$

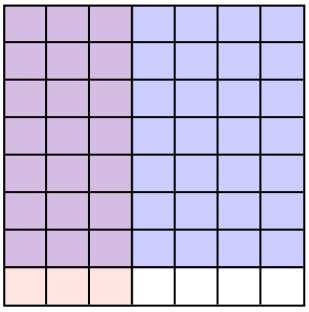

9) $\frac{2}{5} \times \frac{3}{7} =$

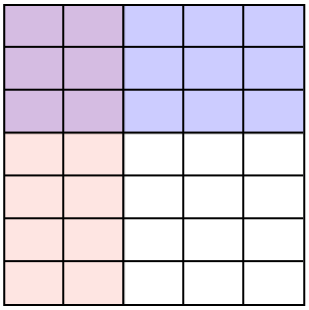

10) $\frac{1}{2} \times \frac{6}{8} =$

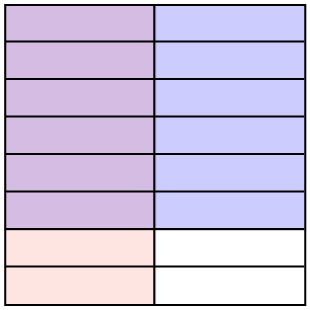

11) $\frac{3}{5} \times \frac{2}{4} =$

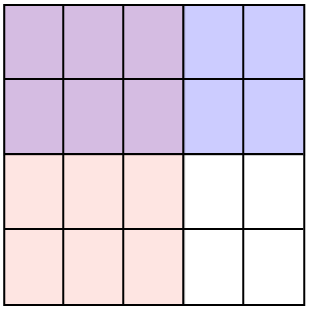

Respuestas

Ej.	4/72
1.	4/35
2.	4/12
3.	3/24
4.	12/45
5.	15/42
6.	2/9
7.	15/45
8.	21/56
9.	6/35
10.	6/16
11.	6/20

1-10	91	82	73	64	55	45	36	27	18	9
11	0									

Multiplicando Fracciones (visualmente) Nombre:

Usa la caja para mostrar de manera visual cómo multiplicar dos fracciones.

Ej) $\frac{1}{3} \times \frac{2}{4} =$

1) $\frac{1}{6} \times \frac{3}{6} =$

2) $\frac{4}{7} \times \frac{4}{5} =$

3) $\frac{1}{4} \times \frac{1}{3} =$

4) $\frac{2}{8} \times \frac{5}{8} =$

5) $\frac{3}{4} \times \frac{7}{9} =$

6) $\frac{5}{6} \times \frac{1}{2} =$

7) $\frac{4}{5} \times \frac{3}{7} =$

8) $\frac{8}{9} \times \frac{1}{2} =$

9) $\frac{7}{8} \times \frac{4}{8} =$

10) $\frac{2}{6} \times \frac{4}{7} =$

11) $\frac{1}{2} \times \frac{1}{2} =$

Respuestas

Ej. $^{2}/_{12}$

1. _____
2. _____
3. _____
4. _____
5. _____
6. _____
7. _____
8. _____
9. _____
10. _____
11. _____

1-10	91	82	73	64	55	45	36	27	18	9
11	0									

Usa la caja para mostrar de manera visual cómo multiplicar dos fracciones.

Ej) $\frac{1}{3} \times \frac{2}{4} =$



1) $\frac{1}{6} \times \frac{3}{6} =$

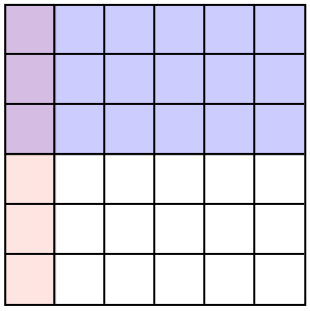

2) $\frac{4}{7} \times \frac{4}{5} =$

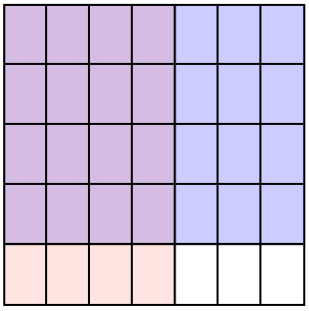

3) $\frac{1}{4} \times \frac{1}{3} =$



4) $\frac{2}{8} \times \frac{5}{8} =$

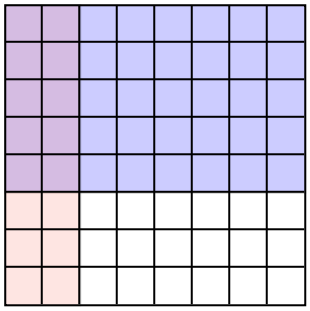

5) $\frac{3}{4} \times \frac{7}{9} =$

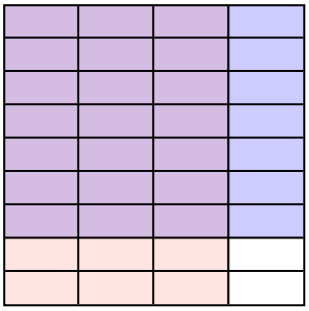

6) $\frac{5}{6} \times \frac{1}{2} =$

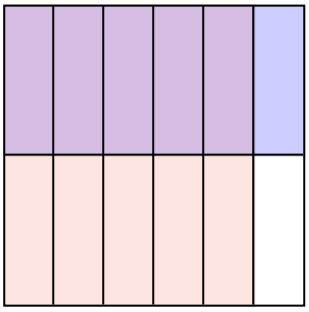

7) $\frac{4}{5} \times \frac{3}{7} =$

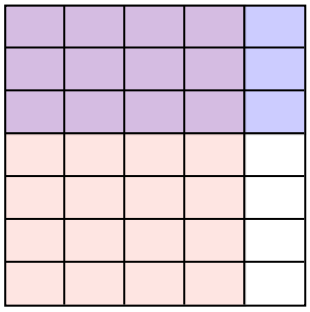

8) $\frac{8}{9} \times \frac{1}{2} =$

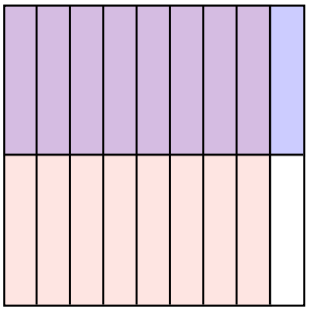

9) $\frac{7}{8} \times \frac{4}{8} =$

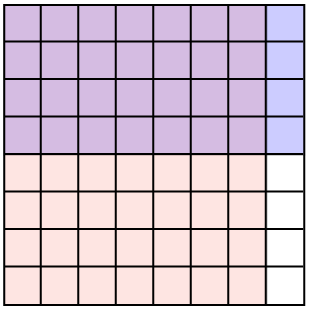

10) $\frac{2}{6} \times \frac{4}{7} =$

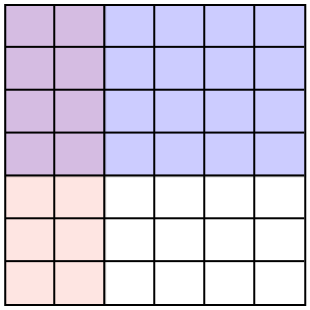

11) $\frac{1}{2} \times \frac{1}{2} =$



Respuestas

Ej.	2/12
1.	3/36
2.	16/35
3.	1/12
4.	10/64
5.	21/36
6.	5/12
7.	12/35
8.	8/18
9.	28/64
10.	8/42
11.	1/4

1-10	91	82	73	64	55	45	36	27	18	9
11	0									