Fracciones Impropias y Mixtas (Visual)

Nombre:

Escribe cada cantidad como un número mixto.

1)

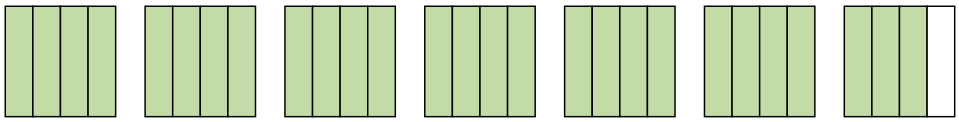

2)

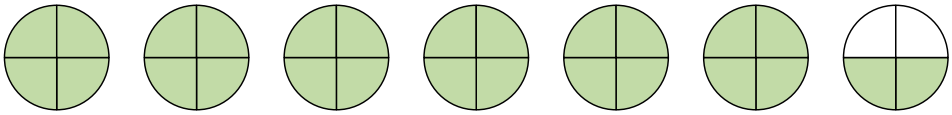

3)

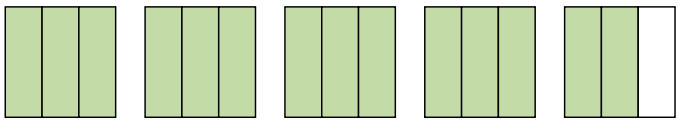

4)



5)

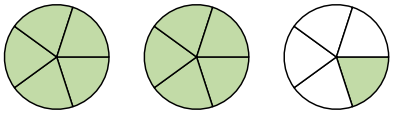

Escriba cada cantidad como una fracción impropia.

6)

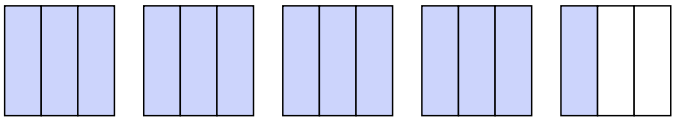

7)

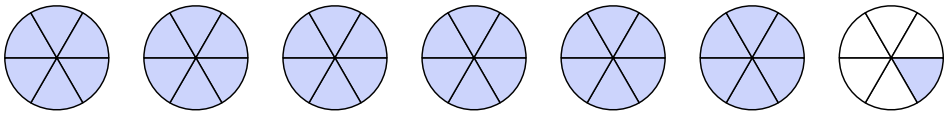

8)

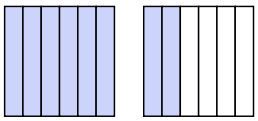

9)

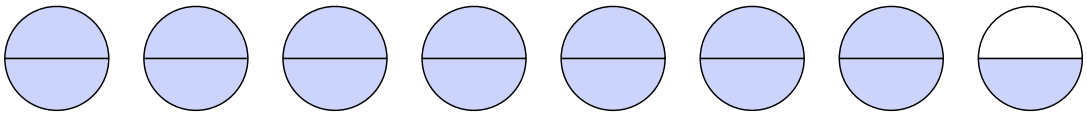

10)

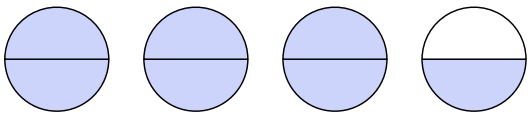

11)

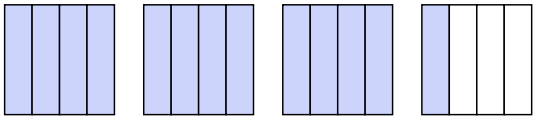

Respuestas

1. _____
2. _____
3. _____
4. _____
5. _____
6. _____
7. _____
8. _____
9. _____
10. _____
11. _____

Matemáticas www.CommonCoreSheets.es

1-10	91	82	73	64	55	45	36	27	18	9
11	0									

Fracciones Impropias y Mixtas (Visual) Nombre: **Clave De Respuestas**

Escribe cada cantidad como un número mixto.

1) 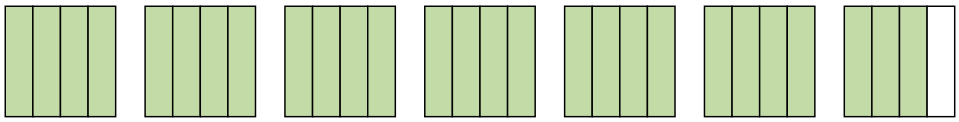

2) 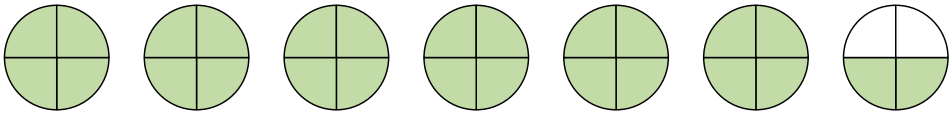

3) 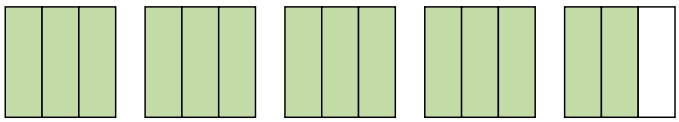

4) 

5) 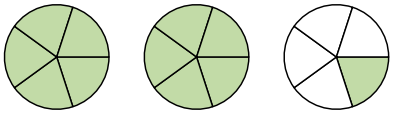

Escriba cada cantidad como una fracción impropia.

6) 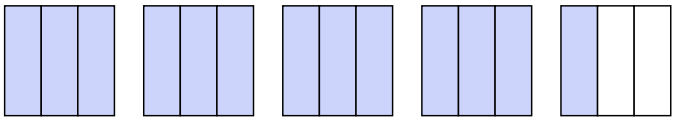

7) 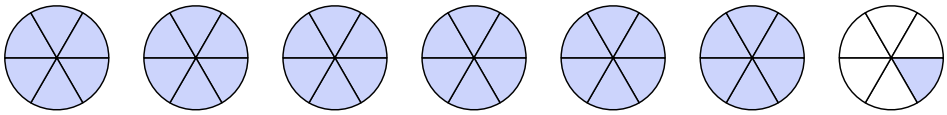

8) 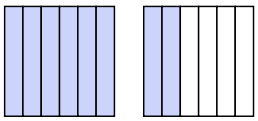

9) 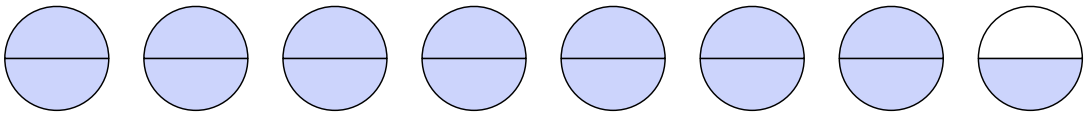

10) 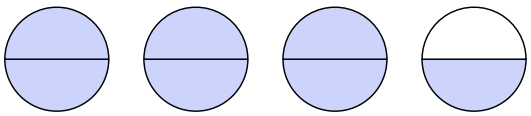

11) 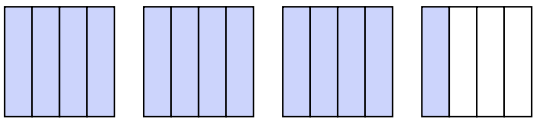

Respuestas

1. $6\frac{3}{4}$
2. $6\frac{2}{4}$
3. $4\frac{2}{3}$
4. $4\frac{4}{6}$
5. $2\frac{1}{5}$
6. $\frac{13}{3}$
7. $\frac{37}{6}$
8. $\frac{8}{6}$
9. $\frac{15}{2}$
10. $\frac{7}{2}$
11. $\frac{13}{4}$

1-10	91	82	73	64	55	45	36	27	18	9
11	0									