Expresar fracciones en forma escrita Nombre:

Escriba la cantidad sombreada en forma escrita.

Ej)

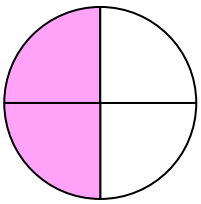

1)

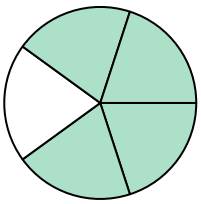

2)

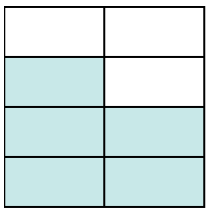

3)

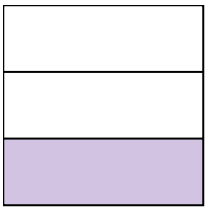

4)

5)

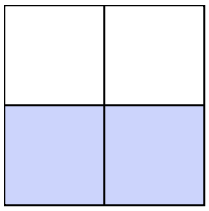

6)



7)

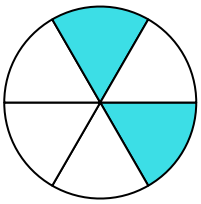

8)

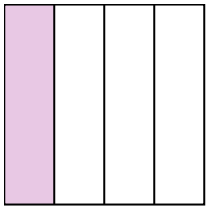

9)



10)

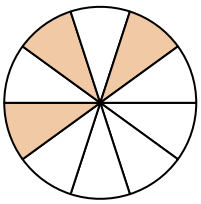

11)

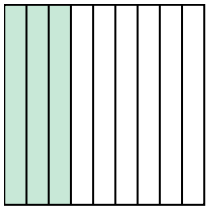

12)

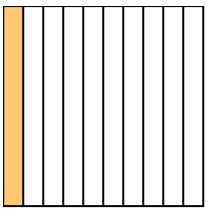

13)

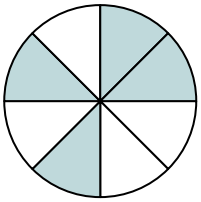

14)

Respuestas

Ej. dos cuartos

1. _____
2. _____
3. _____
4. _____
5. _____
6. _____
7. _____
8. _____
9. _____
10. _____
11. _____
12. _____
13. _____
14. _____

1-10	93	86	79	71	64	57	50	43	36	29
11-14	21	14	7	0						

Escriba la cantidad sombreada en forma escrita.

Ej)
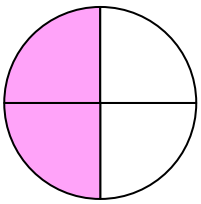

1)
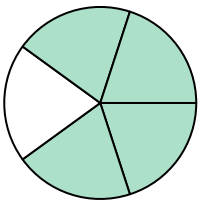

2)
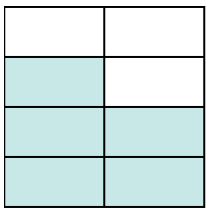

3)
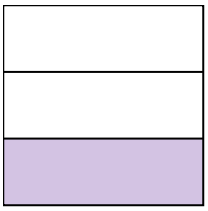

4)

5)
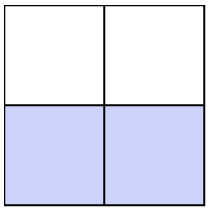

6)


7)
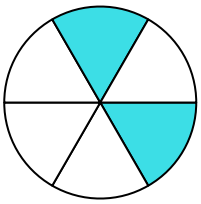

8)
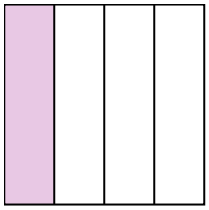

9)


10)
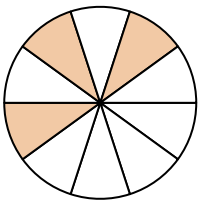

11)
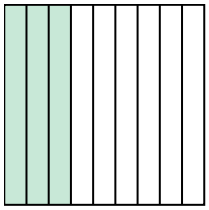

12)
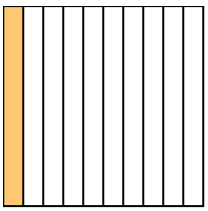

13)
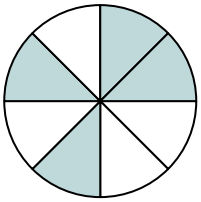

14)

Respuestas

Ej. dos cuartos
1. cuatro quintos
2. cinco séptimos
3. un tercio
4. tres novenos
5. dos tercios
6. una mitad
7. dos sextos
8. un cuarto
9. una mitad
10. tres décimas
11. tres novenos
12. una décima parte
13. cuatro octavos
14. cinco octavos

1-10	93	86	79	71	64	57	50	43	36	29
11-14	21	14	7	0						