Fracción, Decimal y Porcentaje (Visual) Nombre:

Determina el valor escrito como fracción, decimal y porcentaje.

Ej)



fracción $^{86}/_{100}$
décimal 0.86
porcentaje 86

1)



fracción _____
décimal _____
porcentaje _____

2)

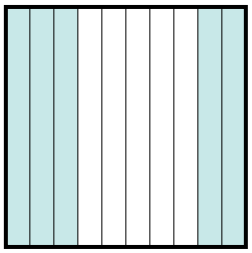

fracción _____
décimal _____
porcentaje _____

3)

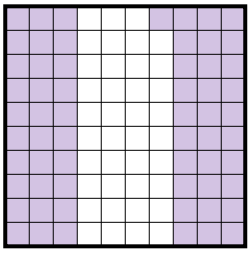

fracción _____
décimal _____
porcentaje _____

4)

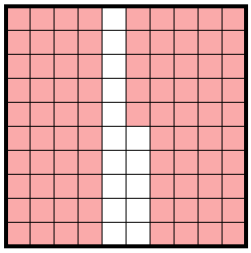

fracción _____
décimal _____
porcentaje _____

5)

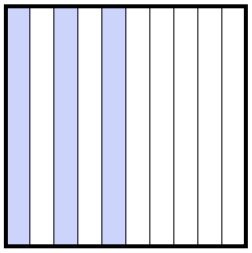

fracción _____
décimal _____
porcentaje _____

6)

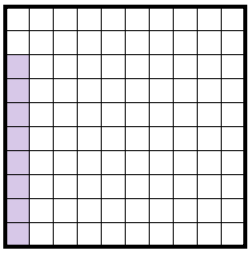

fracción _____
décimal _____
porcentaje _____

7)

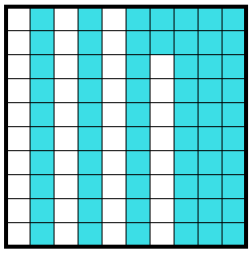

fracción _____
décimal _____
porcentaje _____

8)

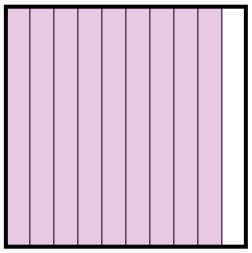

fracción _____
décimal _____
porcentaje _____

9)

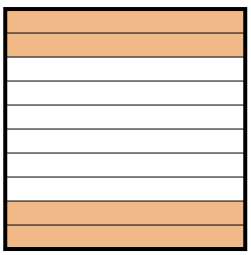

fracción _____
décimal _____
porcentaje _____

10)

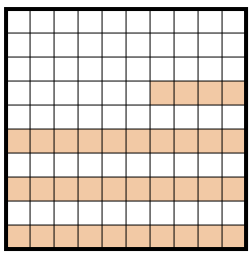

fracción _____
décimal _____
porcentaje _____

11)



fracción _____
décimal _____
porcentaje _____

Respuestas

Ej.	$^{86}/_{100}$	0.86	86%
1.			
2.			
3.			
4.			
5.			
6.			
7.			
8.			
9.			
10.			
11.			

1-10	91	82	73	64	55	45	36	27	18	9
11	0									

Determina el valor escrito como fracción, decimal y porcentaje.

Ej)



fracción $^{86}/_{100}$
décimal 0.86
porcentaje 86

1)



fracción $^{2}/_{10}$
décimal 0.2
porcentaje 20

2)

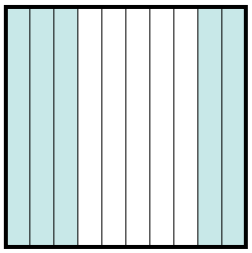

fracción $^{5}/_{10}$
décimal 0.5
porcentaje 50

3)

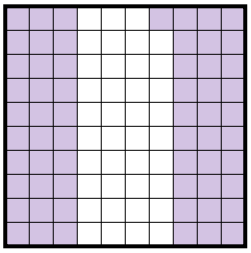

fracción $^{61}/_{100}$
décimal 0.61
porcentaje 61

4)

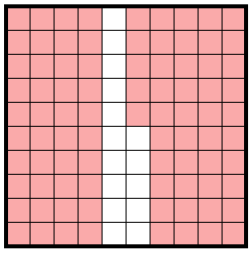

fracción $^{85}/_{100}$
décimal 0.85
porcentaje 85

5)

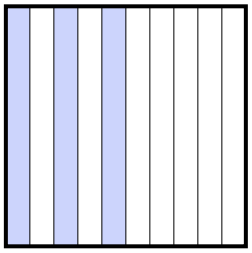

fracción $^{3}/_{10}$
décimal 0.3
porcentaje 30

6)

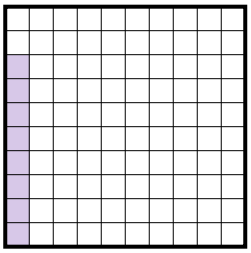

fracción $^{8}/_{100}$
décimal 0.08
porcentaje 8

7)

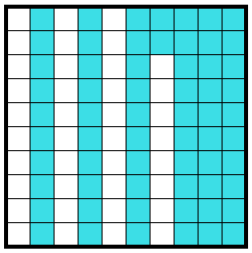

fracción $^{62}/_{100}$
décimal 0.62
porcentaje 62

8)

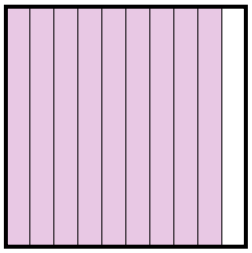

fracción $^{9}/_{10}$
décimal 0.9
porcentaje 90

9)

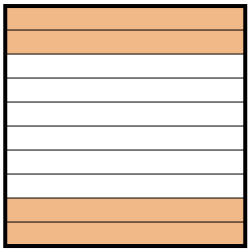

fracción $^{4}/_{10}$
décimal 0.4
porcentaje 40

10)

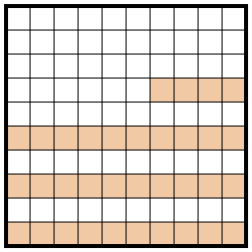

fracción $^{34}/_{100}$
décimal 0.34
porcentaje 34

11)



fracción $^{7}/_{10}$
décimal 0.7
porcentaje 70

Respuestas

Ej.	$^{86}/_{100}$	0.86	86%
1.	$^{2}/_{10}$	0.2	20%
2.	$^{5}/_{10}$	0.5	50%
3.	$^{61}/_{100}$	0.61	61%
4.	$^{85}/_{100}$	0.85	85%
5.	$^{3}/_{10}$	0.3	30%
6.	$^{8}/_{100}$	0.08	8%
7.	$^{62}/_{100}$	0.62	62%
8.	$^{9}/_{10}$	0.9	90%
9.	$^{4}/_{10}$	0.4	40%
10.	$^{34}/_{100}$	0.34	34%
11.	$^{7}/_{10}$	0.7	70%

1-10	91	82	73	64	55	45	36	27	18	9
11	0									