Fracción, Decimal y Porcentaje (Visual) Nombre:

Determina el valor escrito como fracción, decimal y porcentaje.

Ej)

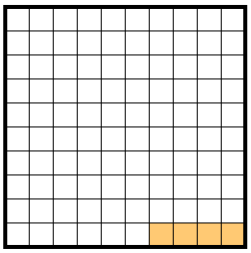

fracción $^{4}/_{100}$
décimal 0.04
porcentaje 4

1)

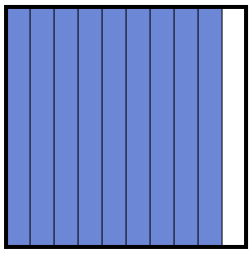

fracción _____
décimal _____
porcentaje _____

2)



fracción _____
décimal _____
porcentaje _____

3)



fracción _____
décimal _____
porcentaje _____

4)

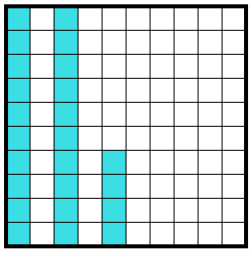

fracción _____
décimal _____
porcentaje _____

5)

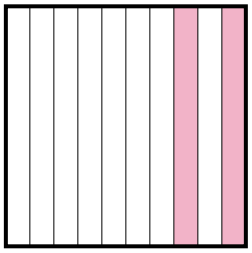

fracción _____
décimal _____
porcentaje _____

6)

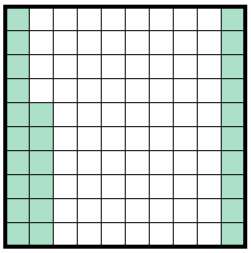

fracción _____
décimal _____
porcentaje _____

7)

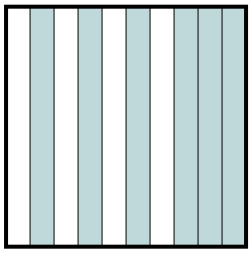

fracción _____
décimal _____
porcentaje _____

8)

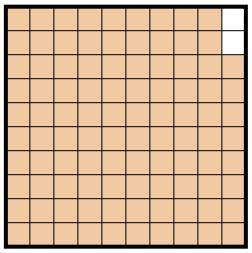

fracción _____
décimal _____
porcentaje _____

9)

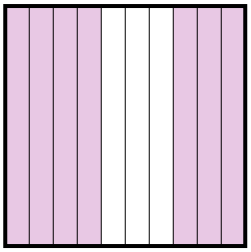

fracción _____
décimal _____
porcentaje _____

10)

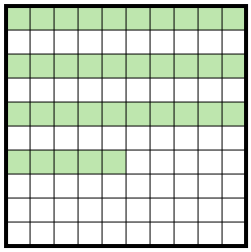

fracción _____
décimal _____
porcentaje _____

11)



fracción _____
décimal _____
porcentaje _____

Respuestas

Ej.	$^{4}/_{100}$	0.04	4%
1.			
2.			
3.			
4.			
5.			
6.			
7.			
8.			
9.			
10.			
11.			

1-10	91	82	73	64	55	45	36	27	18	9
11	0									

Determina el valor escrito como fracción, decimal y porcentaje.

Ej)

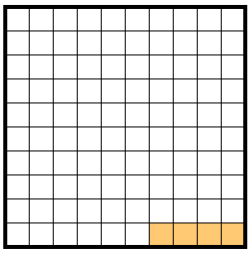

fracción $^{4}/_{100}$
décimal 0.04
porcentaje 4

1)

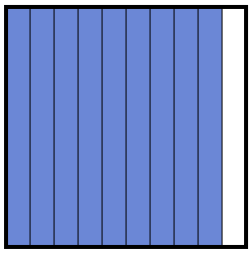

fracción $^{9}/_{10}$
décimal 0.9
porcentaje 90

2)



fracción $^{8}/_{10}$
décimal 0.8
porcentaje 80

3)



fracción $^{3}/_{10}$
décimal 0.3
porcentaje 30

4)

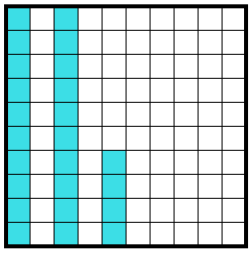

fracción $^{24}/_{100}$
décimal 0.24
porcentaje 24

5)

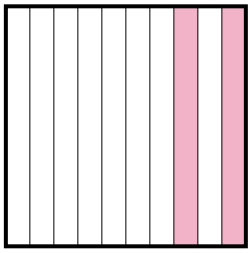

fracción $^{2}/_{10}$
décimal 0.2
porcentaje 20

6)

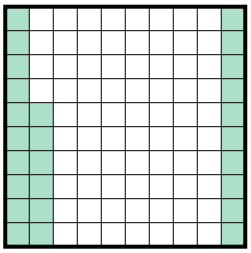

fracción $^{26}/_{100}$
décimal 0.26
porcentaje 26

7)

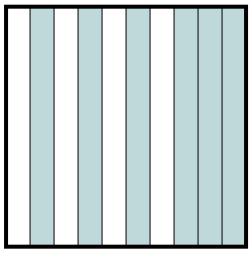

fracción $^{6}/_{10}$
décimal 0.6
porcentaje 60

8)

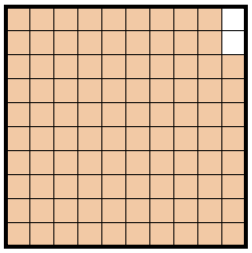

fracción $^{98}/_{100}$
décimal 0.98
porcentaje 98

9)

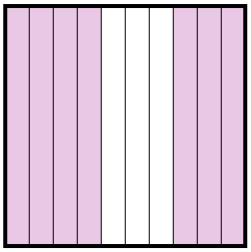

fracción $^{7}/_{10}$
décimal 0.7
porcentaje 70

10)

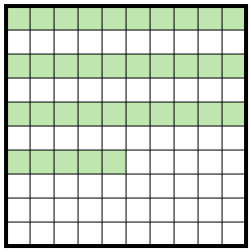

fracción $^{35}/_{100}$
décimal 0.35
porcentaje 35

11)



fracción $^{16}/_{100}$
décimal 0.16
porcentaje 16

Respuestas

Ej.	$^{4}/_{100}$	0.04	4%
1.	$^{9}/_{10}$	0.9	90%
2.	$^{8}/_{10}$	0.8	80%
3.	$^{3}/_{10}$	0.3	30%
4.	$^{24}/_{100}$	0.24	24%
5.	$^{2}/_{10}$	0.2	20%
6.	$^{26}/_{100}$	0.26	26%
7.	$^{6}/_{10}$	0.6	60%
8.	$^{98}/_{100}$	0.98	98%
9.	$^{7}/_{10}$	0.7	70%
10.	$^{35}/_{100}$	0.35	35%
11.	$^{16}/_{100}$	0.16	16%

1-10	91	82	73	64	55	45	36	27	18	9
11	0									