Fracción, Decimal y Porcentaje (Visual)

Nombre:

Determina el valor escrito como fracción, decimal y porcentaje.

Ej)

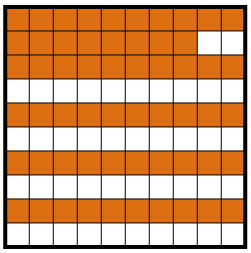

fracción $^{58}/_{100}$
décimal 0.58
porcentaje 58

1)

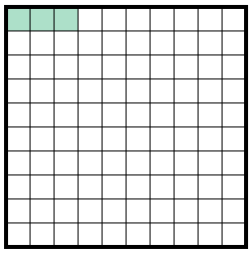

fracción _____
décimal _____
porcentaje _____

2)

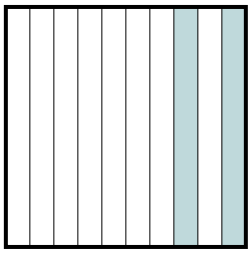

fracción _____
décimal _____
porcentaje _____

3)

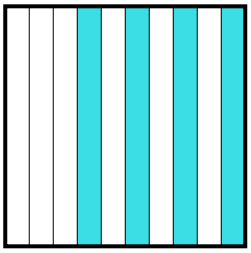

fracción _____
décimal _____
porcentaje _____

4)

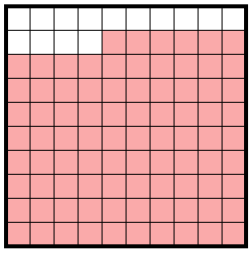

fracción _____
décimal _____
porcentaje _____

5)

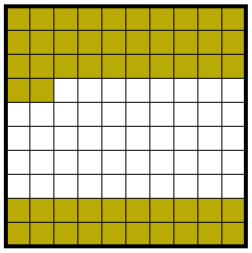

fracción _____
décimal _____
porcentaje _____

6)

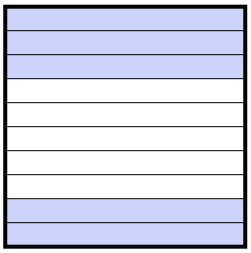

fracción _____
décimal _____
porcentaje _____

7)

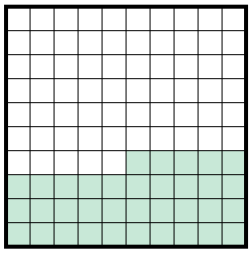

fracción _____
décimal _____
porcentaje _____

8)

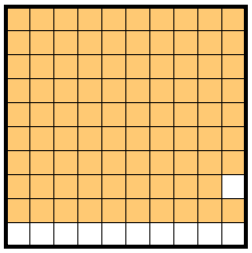

fracción _____
décimal _____
porcentaje _____

9)

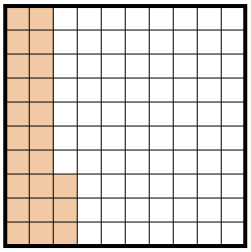

fracción _____
décimal _____
porcentaje _____

10)

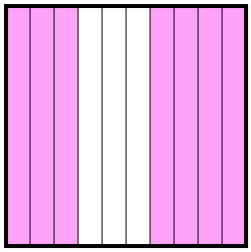

fracción _____
décimal _____
porcentaje _____

11)

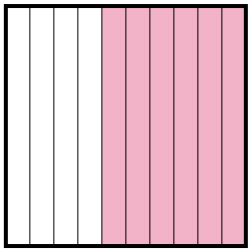

fracción _____
décimal _____
porcentaje _____

Respuestas

Ej.	$^{58}/_{100}$	0.58	58%
1.			
2.			
3.			
4.			
5.			
6.			
7.			
8.			
9.			
10.			
11.			

1-10	91	82	73	64	55	45	36	27	18	9
11	0									

Determina el valor escrito como fracción, decimal y porcentaje.

Ej)

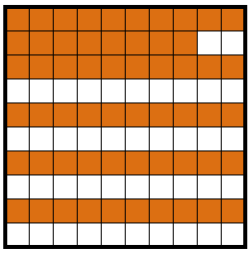

fracción $^{58}/_{100}$
décimal 0.58
porcentaje 58

1)

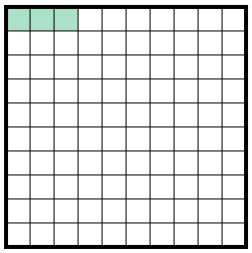

fracción $^{3}/_{100}$
décimal 0.03
porcentaje 3

2)

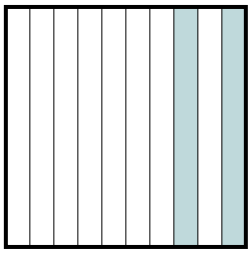

fracción $^{2}/_{10}$
décimal 0.2
porcentaje 20

3)

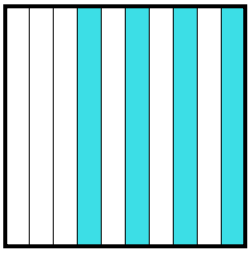

fracción $^{4}/_{10}$
décimal 0.4
porcentaje 40

4)

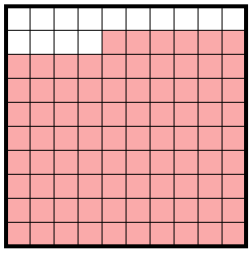

fracción $^{86}/_{100}$
décimal 0.86
porcentaje 86

5)

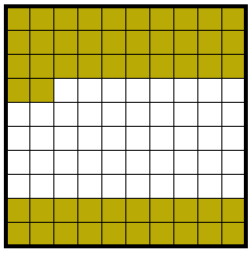

fracción $^{52}/_{100}$
décimal 0.52
porcentaje 52

6)

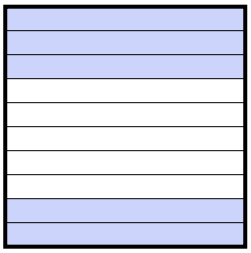

fracción $^{5}/_{10}$
décimal 0.5
porcentaje 50

7)

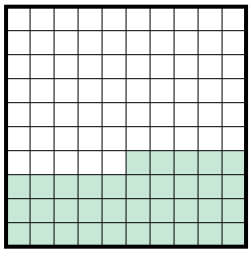

fracción $^{35}/_{100}$
décimal 0.35
porcentaje 35

8)

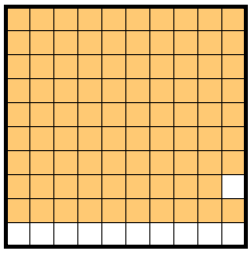

fracción $^{89}/_{100}$
décimal 0.89
porcentaje 89

9)

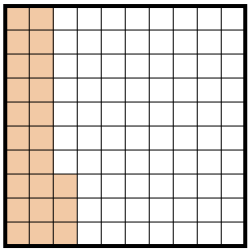

fracción $^{23}/_{100}$
décimal 0.23
porcentaje 23

10)

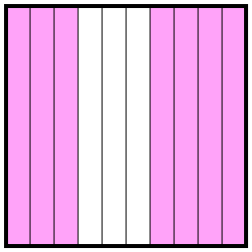

fracción $^{7}/_{10}$
décimal 0.7
porcentaje 70

11)

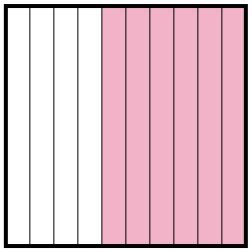

fracción $^{6}/_{10}$
décimal 0.6
porcentaje 60

Respuestas

Ej.	$^{58}/_{100}$	0.58	58%
1.	$^{3}/_{100}$	0.03	3%
2.	$^{2}/_{10}$	0.2	20%
3.	$^{4}/_{10}$	0.4	40%
4.	$^{86}/_{100}$	0.86	86%
5.	$^{52}/_{100}$	0.52	52%
6.	$^{5}/_{10}$	0.5	50%
7.	$^{35}/_{100}$	0.35	35%
8.	$^{89}/_{100}$	0.89	89%
9.	$^{23}/_{100}$	0.23	23%
10.	$^{7}/_{10}$	0.7	70%
11.	$^{6}/_{10}$	0.6	60%

1-10	91	82	73	64	55	45	36	27	18	9
11	0									