Fracción, Decimal y Porcentaje (Visual) Nombre:

**Determina el valor escrito como fracción, decimal y porcentaje.**

**Ej)**

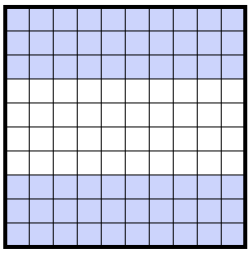

fracción $^{60}/_{100}$
décimal 0.60
porcentaje 60

**1)**

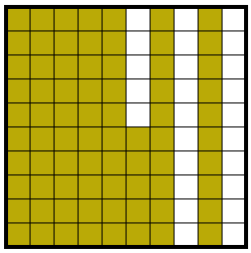

fracción _____
décimal _____
porcentaje _____

**2)**

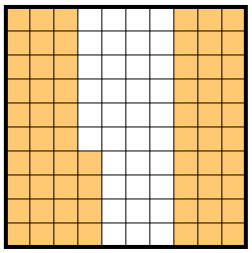

fracción _____
décimal _____
porcentaje _____

**3)**

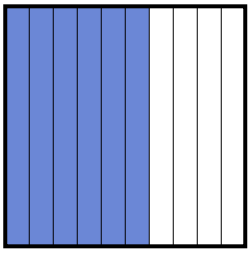

fracción _____
décimal _____
porcentaje _____

**4)**

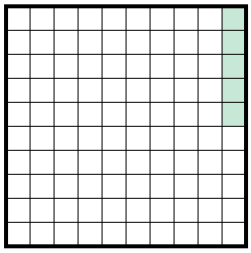

fracción _____
décimal _____
porcentaje _____

**5)**

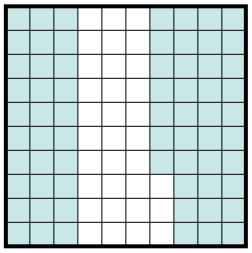

fracción _____
décimal _____
porcentaje _____

**6)**

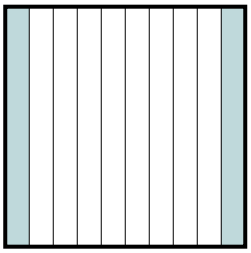

fracción _____
décimal _____
porcentaje _____

**7)**

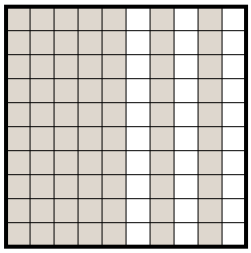

fracción _____
décimal _____
porcentaje _____

**8)**

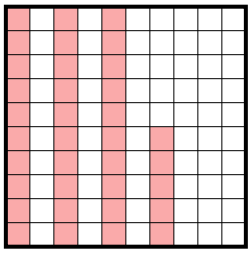

fracción _____
décimal _____
porcentaje _____

**9)**



fracción _____
décimal _____
porcentaje _____

**10)**



fracción _____
décimal _____
porcentaje _____

**11)**

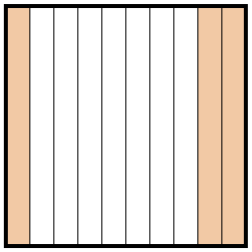

fracción _____
décimal _____
porcentaje _____

## Respuestas

| | | | |
|---|---|---|---|
| Ej. | $^{60}/_{100}$ | 0.60 | 60% |
| 1. | | | |
| 2. | | | |
| 3. | | | |
| 4. | | | |
| 5. | | | |
| 6. | | | |
| 7. | | | |
| 8. | | | |
| 9. | | | |
| 10. | | | |
| 11. | | | |



| | | | | | | | | | | |
|---|---|---|---|---|---|---|---|---|---|---|
| 1-10 | 91 | 82 | 73 | 64 | 55 | 45 | 36 | 27 | 18 | 9 |
| 11 | 0 | | | | | | | | | |

**Determina el valor escrito como fracción, decimal y porcentaje.**

**Ej)**

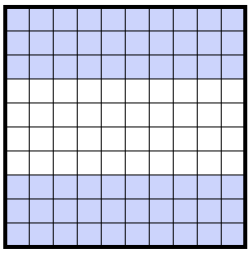

fracción $^{60}/_{100}$
décimal 0.60
porcentaje 60

**1)**

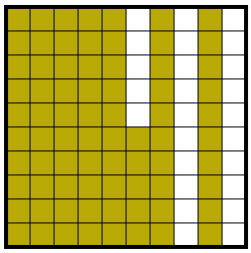

fracción $^{75}/_{100}$
décimal 0.75
porcentaje 75

**2)**

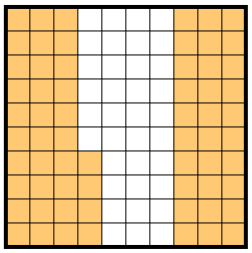

fracción $^{64}/_{100}$
décimal 0.64
porcentaje 64

**3)**

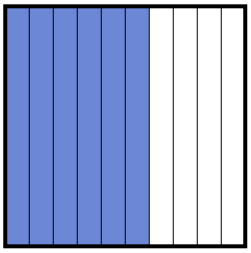

fracción $^{6}/_{10}$
décimal 0.6
porcentaje 60

**4)**

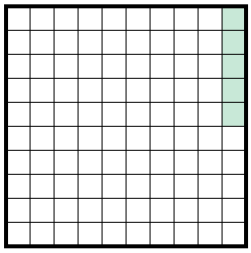

fracción $^{5}/_{100}$
décimal 0.05
porcentaje 5

**5)**

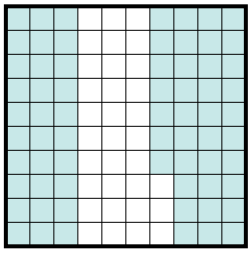

fracción $^{67}/_{100}$
décimal 0.67
porcentaje 67

**6)**

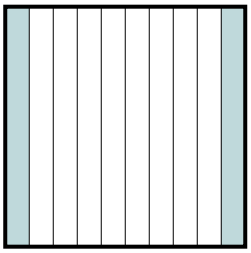

fracción $^{2}/_{10}$
décimal 0.2
porcentaje 20

**7)**

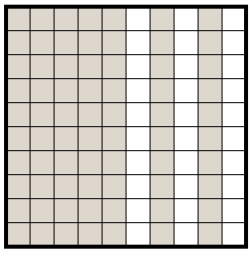

fracción $^{70}/_{100}$
décimal 0.70
porcentaje 70

**8)**

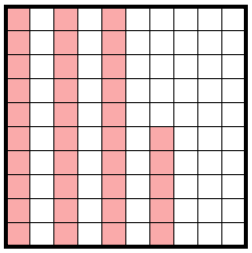

fracción $^{35}/_{100}$
décimal 0.35
porcentaje 35

**9)**



fracción $^{9}/_{10}$
décimal 0.9
porcentaje 90

**10)**



fracción $^{8}/_{10}$
décimal 0.8
porcentaje 80

**11)**

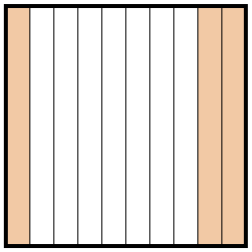

fracción $^{3}/_{10}$
décimal 0.3
porcentaje 30

## Respuestas

| | | | |
|---|---|---|---|
| Ej. | $^{60}/_{100}$ | 0.60 | 60% |
| 1. | $^{75}/_{100}$ | 0.75 | 75% |
| 2. | $^{64}/_{100}$ | 0.64 | 64% |
| 3. | $^{6}/_{10}$ | 0.6 | 60% |
| 4. | $^{5}/_{100}$ | 0.05 | 5% |
| 5. | $^{67}/_{100}$ | 0.67 | 67% |
| 6. | $^{2}/_{10}$ | 0.2 | 20% |
| 7. | $^{70}/_{100}$ | 0.70 | 70% |
| 8. | $^{35}/_{100}$ | 0.35 | 35% |
| 9. | $^{9}/_{10}$ | 0.9 | 90% |
| 10. | $^{8}/_{10}$ | 0.8 | 80% |
| 11. | $^{3}/_{10}$ | 0.3 | 30% |



| | | | | | | | | | | |
|---|---|---|---|---|---|---|---|---|---|---|
| 1-10 | 91 | 82 | 73 | 64 | 55 | 45 | 36 | 27 | 18 | 9 |
| 11 | 0 | | | | | | | | | |