Encontrando el área con unidades cuadradas de mosaicos Nombre:

Encuentra el área dividiendo los rectángulos mostrados. El primero ya está dividido.

1)

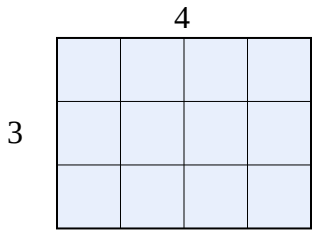

2)

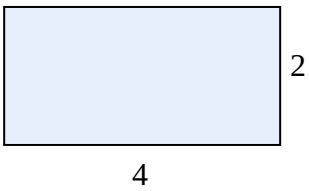

3)

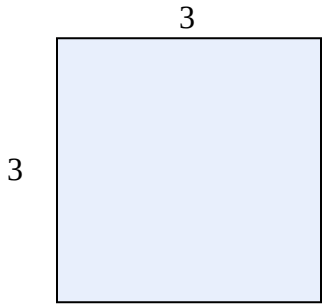

4)

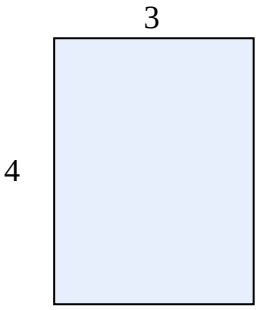

5)



6)

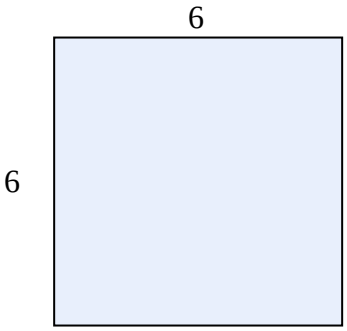

7)

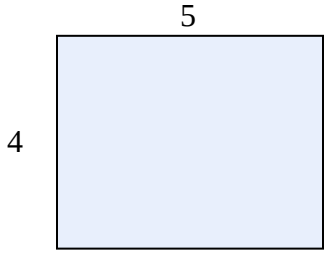

8)



9)

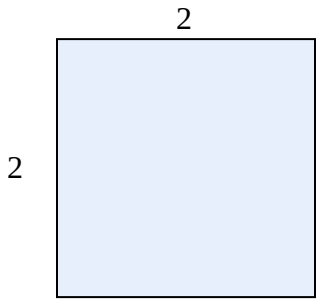

10)

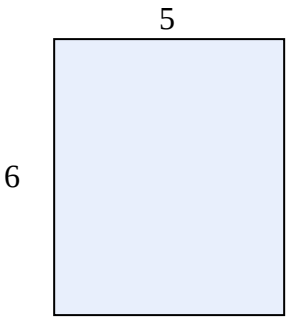

Respuestas

1. _____
2. _____
3. _____
4. _____
5. _____
6. _____
7. _____
8. _____
9. _____
10. _____

1-10	90	80	70	60	50	40	30	20	10	0

Encontrando el área con unidades cuadradas de mosaicos Nombre: **Clave De Respuestas**

Encuentra el área dividiendo los rectángulos mostrados. El primero ya está dividido.

1)

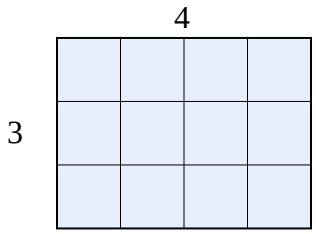

2)

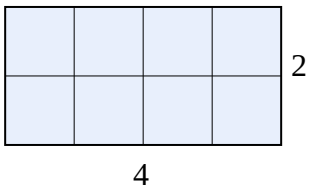

3)

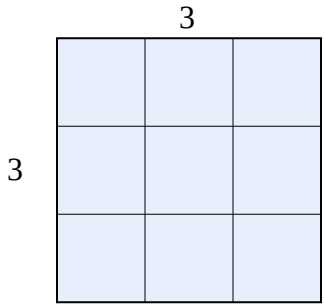

4)

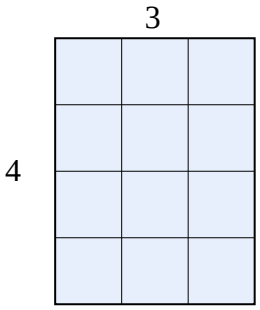

5)

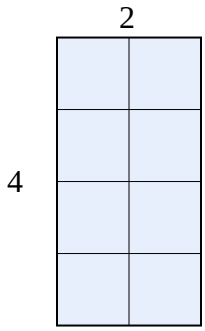

6)

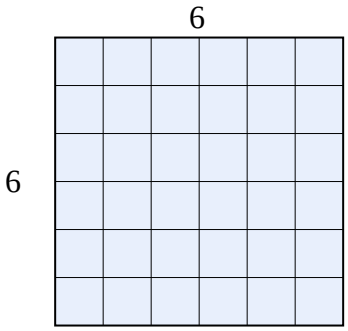

7)

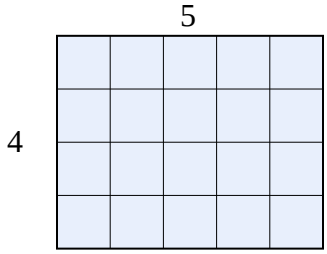

8)

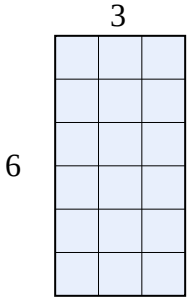

9)

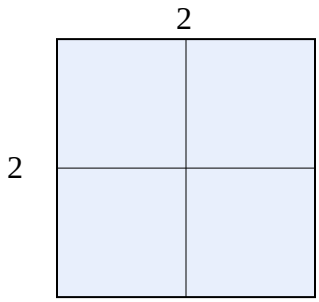

10)

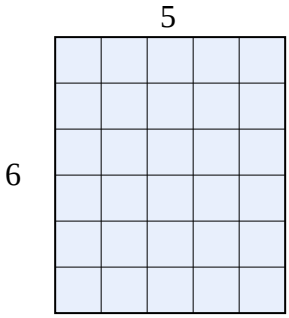

Respuestas

1. **12**
2. **8**
3. **9**
4. **12**
5. **8**
6. **36**
7. **20**
8. **18**
9. **4**
10. **30**

1-10	90	80	70	60	50	40	30	20	10	0