Encontrando volumen con unidades de cubos Nombre:

Encuentra el largo, ancho y alto del prisma rectanguar. Después encuentra el volumen.

Ej)

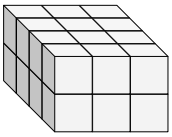

1)

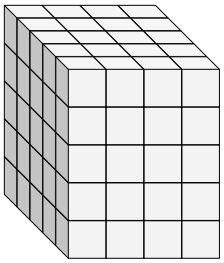

2)

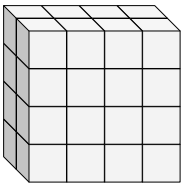

3)

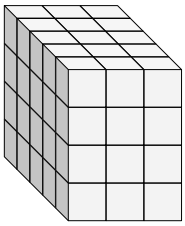

4)

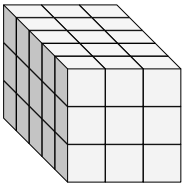

5)

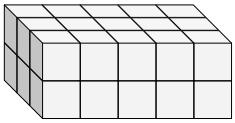

6)

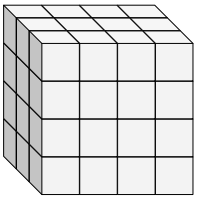

7)

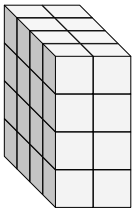

8)

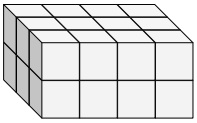

9)

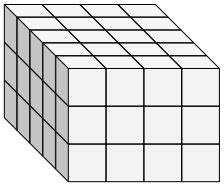

Respuestas

Ej.	4	3	2	24
1.				
2.				
3.				
4.				
5.				
6.				
7.				
8.				
9.				

Encontrando volumen con unidades de cubos

Nombre: **Clave De Respuestas**

Encuentra el largo, ancho y alto del prisma rectanguar. Después encuentra el volumen.

Ej)

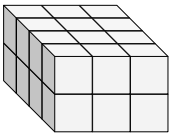

1)

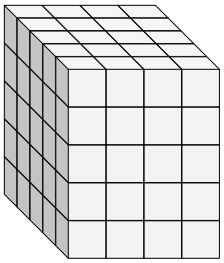

2)

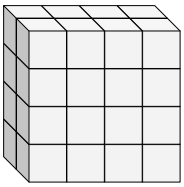

3)

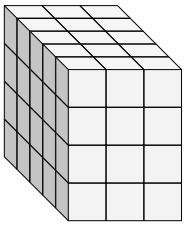

4)

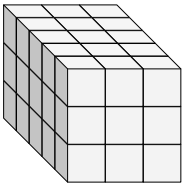

5)

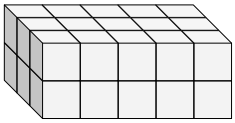

6)

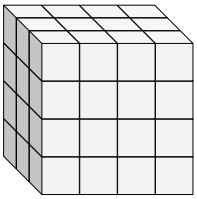

7)

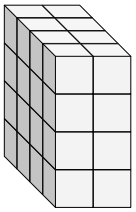

8)

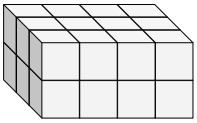

9)

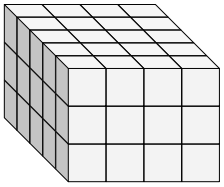

Respuestas

Ej.	4	3	2	24
1.	5	4	5	100
2.	2	4	4	32
3.	5	3	4	60
4.	5	3	3	45
5.	3	5	2	30
6.	3	4	4	48
7.	4	2	4	32
8.	3	4	2	24
9.	5	4	3	60