Encontrando el volumen

Nombre:

Encontrar el volumen de cada prisma rectangular. Recuerda V = Base × Altura y V=Largo × ancho × alto.

1)

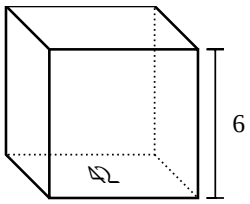

2)

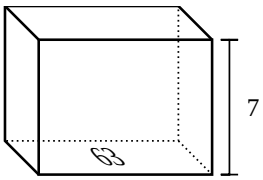

3)

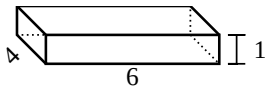

4)

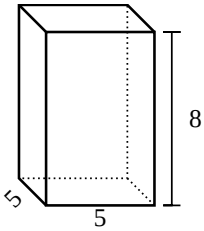

5)

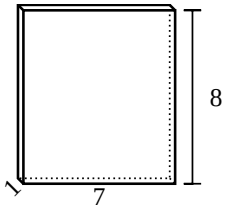

6)

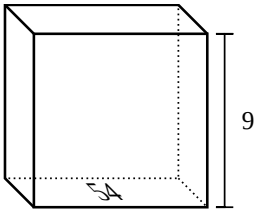

7)

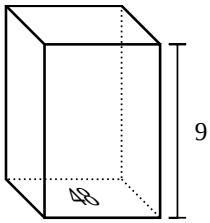

8)

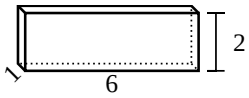

9)

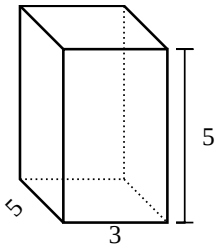

10)

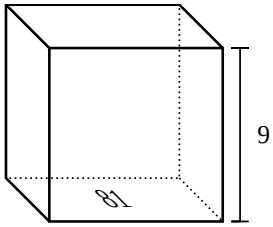

11)

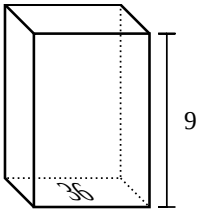

12)

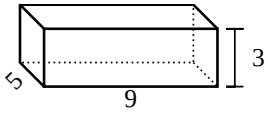

13)

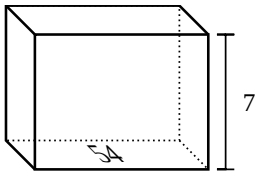

14)

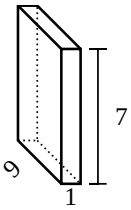

15)

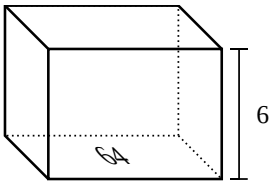

Respuestas

1. _____
2. _____
3. _____
4. _____
5. _____
6. _____
7. _____
8. _____
9. _____
10. _____
11. _____
12. _____
13. _____
14. _____
15. _____

1-10	93	87	80	73	67	60	53	47	40	33
11-15	27	20	13	7	0					

Encontrando el volumen

Nombre: **Clave De Respuestas**

Encontrar el volumen de cada prisma rectangular. Recuerda V = Base × Altura y V=Largo × ancho × alto.

1)

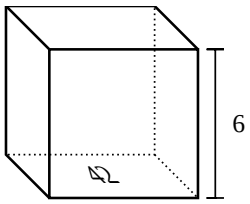

2)

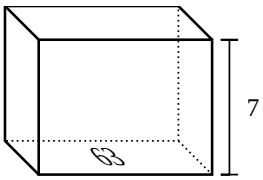

3)

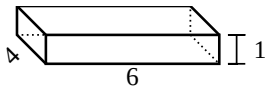

4)

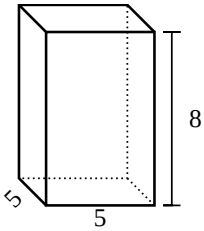

5)

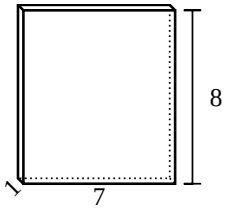

6)

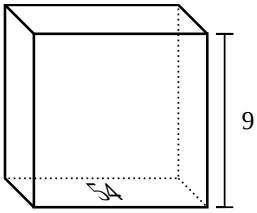

7)

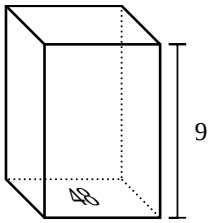

8)

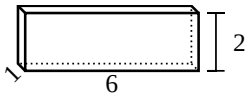

9)

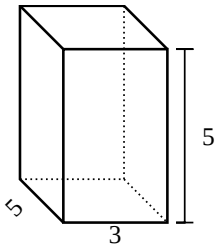

10)

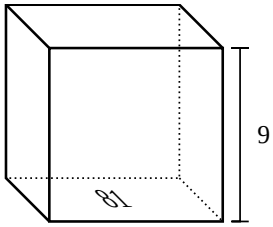

11)

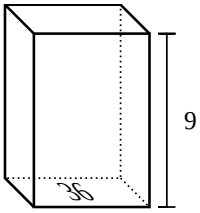

12)

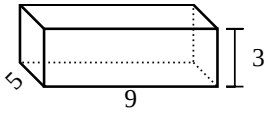

13)

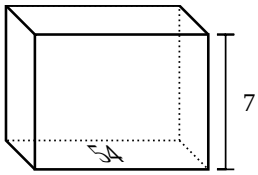

14)

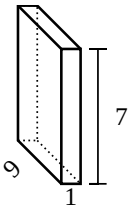

15)

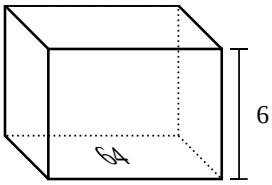

Respuestas

1. 252 cm^3
2. 441 cm^3
3. 24 cm^3
4. 200 cm^3
5. 56 cm^3
6. 486 cm^3
7. 432 cm^3
8. 12 cm^3
9. 75 cm^3
10. 729 cm^3
11. 324 cm^3
12. 135 cm^3
13. 378 cm^3
14. 63 cm^3
15. 384 cm^3

1-10	93	87	80	73	67	60	53	47	40	33
11-15	27	20	13	7	0					