Usando cubos de unidades para determinar el volumen Nombre:

Rellenar cada prisma rectangular con cubos para determinar el volumen. Cada unidad de primsa es medida en cm (no a escala).

Ej)

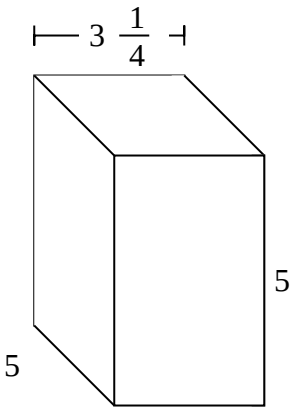

1)

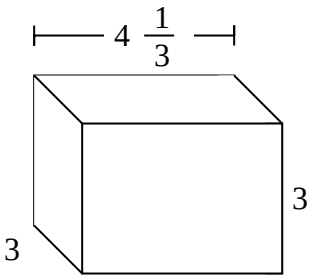

2)

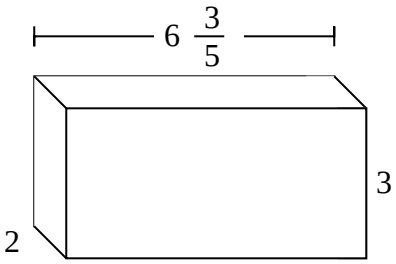

3)

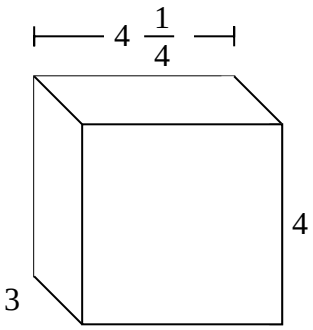

4)

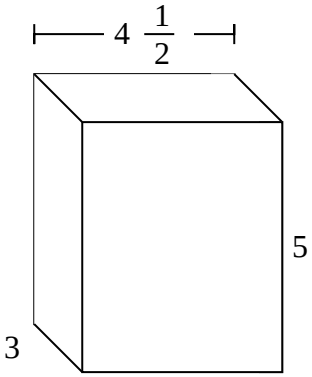

5)

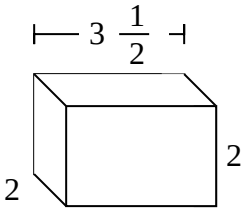

6)

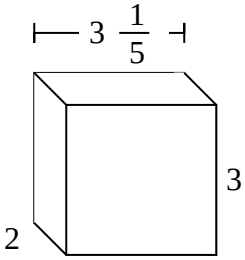

7)

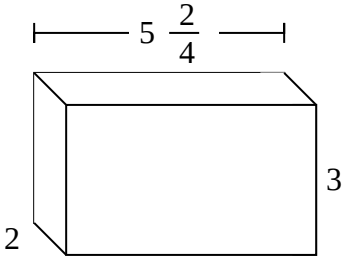

Respuestas

Ej. **81 $^{1}/_{4}$ cm**

1. _____
2. _____
3. _____
4. _____
5. _____
6. _____
7. _____

Usando cubos de unidades para determinar el volumen Nombre: **Clave De Respuestas**

Rellenar cada prisma rectangular con cubos para determinar el volumen. Cada unidad de primsa es medida en cm (no a escala).

Ej)

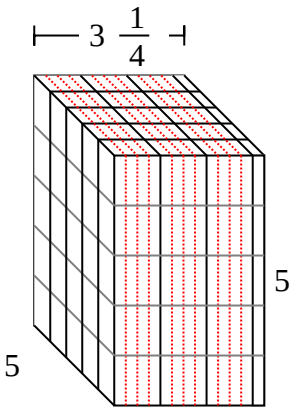

1)

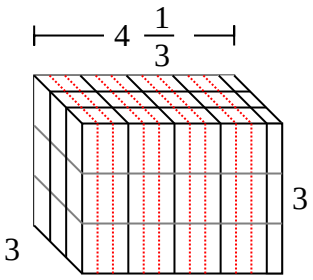

2)

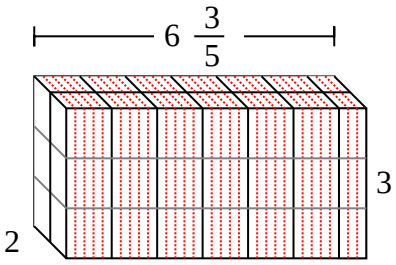

3)

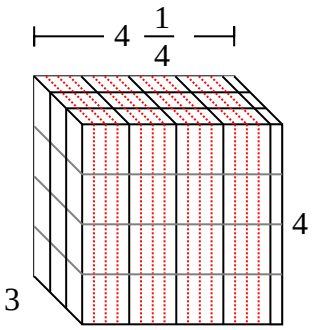

4)

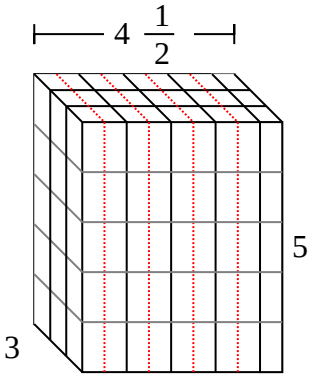

5)

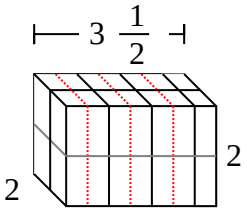

6)

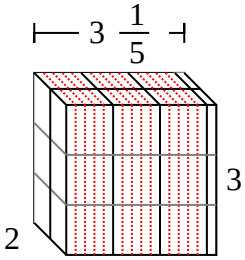

7)

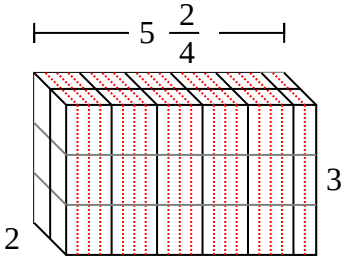

Respuestas

Ej. **81 $^{1}/_{4}$ cm**

1. **39 cm**
2. **39 $^{3}/_{5}$ cm**
3. **51 cm**
4. **67 $^{1}/_{2}$ cm**
5. **14 cm**
6. **19 $^{1}/_{5}$ cm**
7. **33 cm**

1-7	86	71	57	43	29	14	0