Encontrando los ángulos en los círculos Nombre:

Encuentra el ángulo (en grados) de la parte sombreada del círculo.

1)

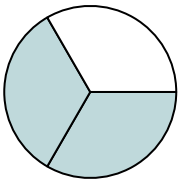

2)

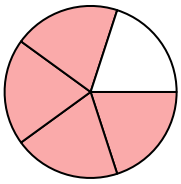

3)

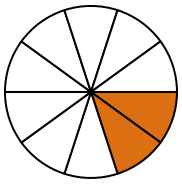

4)

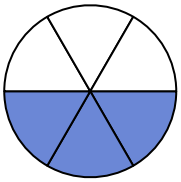

5)

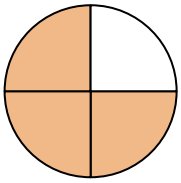

6)

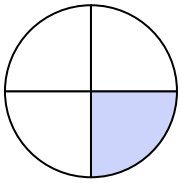

7)

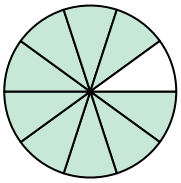

8)

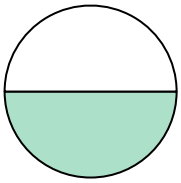

9)

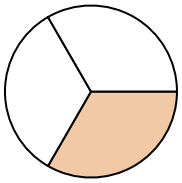

10)

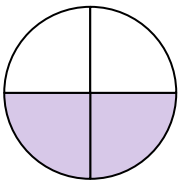

11)

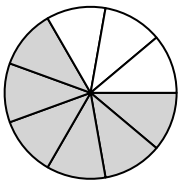

12)

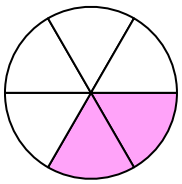

13)

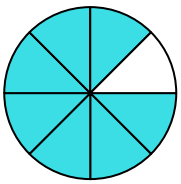

14)

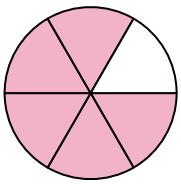

15)

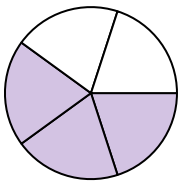

Respuestas

1. _____
2. _____
3. _____
4. _____
5. _____
6. _____
7. _____
8. _____
9. _____
10. _____
11. _____
12. _____
13. _____
14. _____
15. _____

1-10	93	87	80	73	67	60	53	47	40	33
11-15	27	20	13	7	0					

Encontrando los ángulos en los círculos

Nombre: **Clave De Respuestas**

Encuentra el ángulo (en grados) de la parte sombreada del círculo.

1)

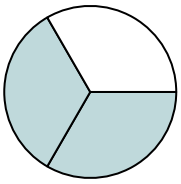

2)

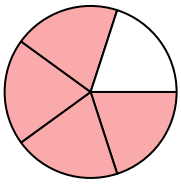

3)

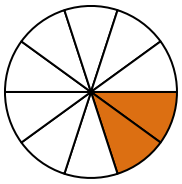

4)

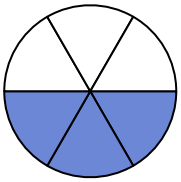

5)

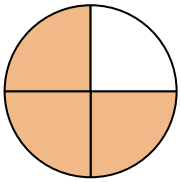

6)

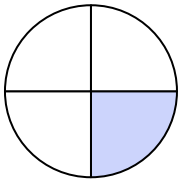

7)

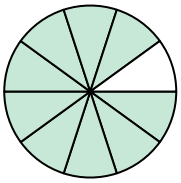

8)

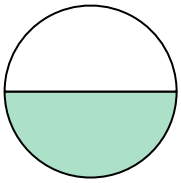

9)

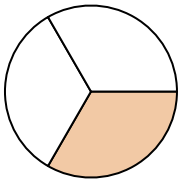

10)

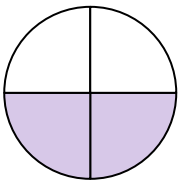

11)

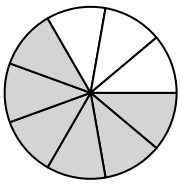

12)

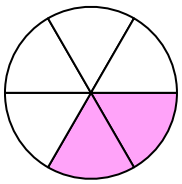

13)

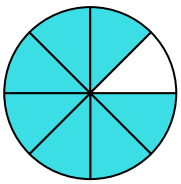

14)

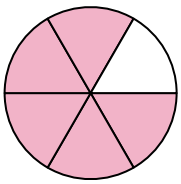

15)

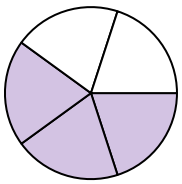

Respuestas

1. **240**
2. **288**
3. **72**
4. **180**
5. **270**
6. **90**
7. **324**
8. **180**
9. **120**
10. **180**
11. **240**
12. **120**
13. **315**
14. **300**
15. **216**

1-10	93	87	80	73	67	60	53	47	40	33
11-15	27	20	13	7	0					

Encontrando los ángulos en los círculos Nombre:

Encuentra el ángulo (en grados) de la parte sombreada del círculo.

90	72	180	324	120
288	240	240	270	120
180	180			

1)

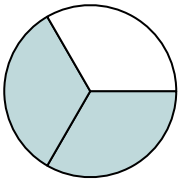

2)

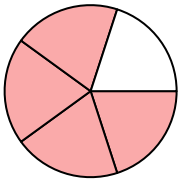

3)

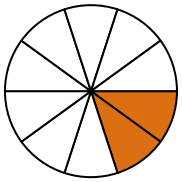

4)

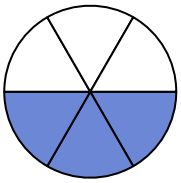

5)

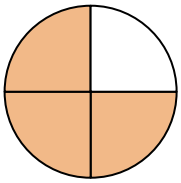

6)

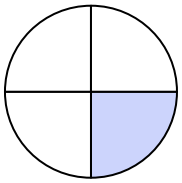

7)

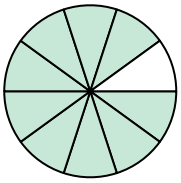

8)

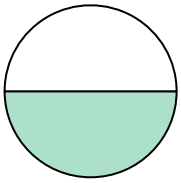

9)

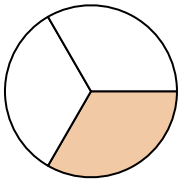

10)

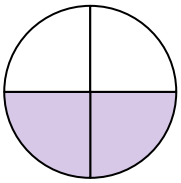

11)

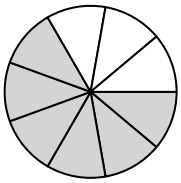

12)

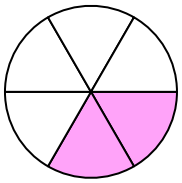

Respuestas

1. _____
2. _____
3. _____
4. _____
5. _____
6. _____
7. _____
8. _____
9. _____
10. _____
11. _____
12. _____

1-10	92	83	75	67	58	50	42	33	25	17
11-12	8	0								