Encontrar los ángulos en las figuras

Nombre:

**Cuenta el número de ángulos Agudos, Obtusos, Rectos y Concavos de cada figura.**

**Ej)**

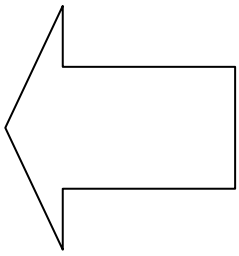

**1)**



**2)**

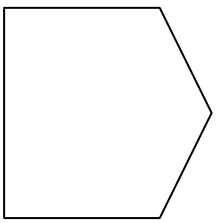

**3)**



**4)**

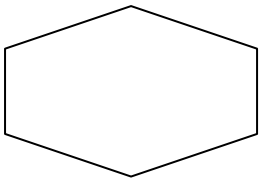

**5)**



**6)**

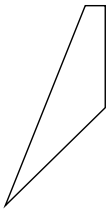

**7)**

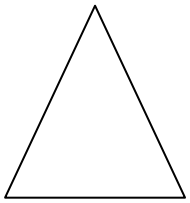

**8)**

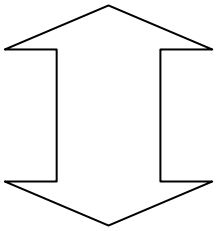

**9)**

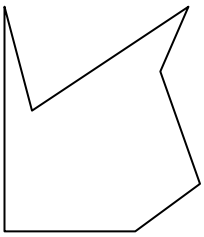

**10)**

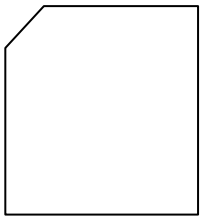

**11)**

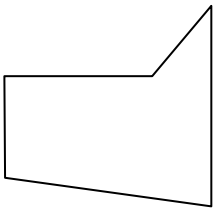

## Respuestas

| | | | | |
|---|---|---|---|---|
| Ej. | 2 | 1 | 2 | 2 |
| 1. | | | | |
| 2. | | | | |
| 3. | | | | |
| 4. | | | | |
| 5. | | | | |
| 6. | | | | |
| 7. | | | | |
| 8. | | | | |
| 9. | | | | |
| 10. | | | | |
| 11. | | | | |



| | | | | | | | | | | |
|---|---|---|---|---|---|---|---|---|---|---|
| 1-10 | 91 | 82 | 73 | 64 | 55 | 45 | 36 | 27 | 18 | 9 |
| 11 | 0 | | | | | | | | | |

Encontrar los ángulos en las figuras

Nombre: **Clave De Respuestas**

**Cuenta el número de ángulos Agudos, Obtusos, Rectos y Concavos de cada figura.**

**Ej)**

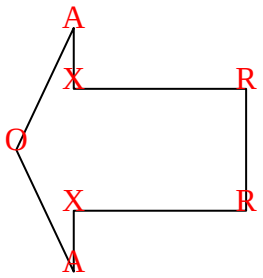


**1)**

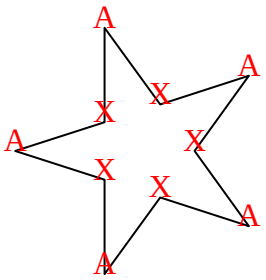


**2)**

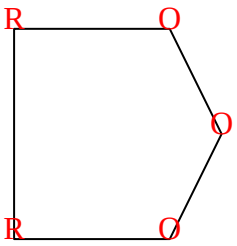


**3)**

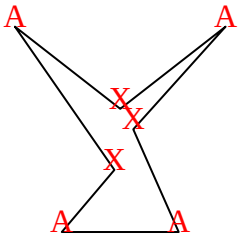


**4)**

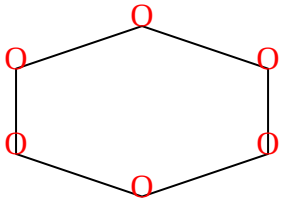


**5)**

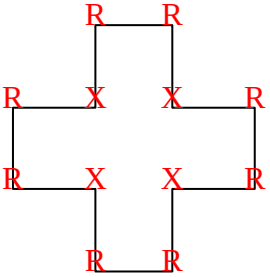


**6)**

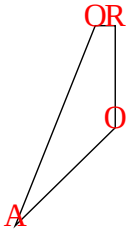


**7)**

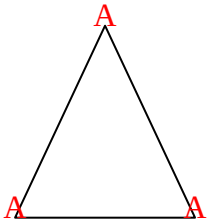


**8)**

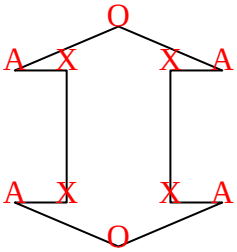


**9)**

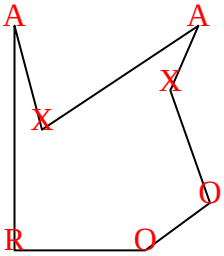


**10)**

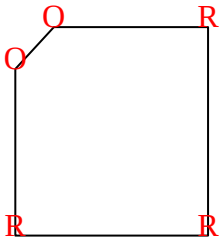


**11)**

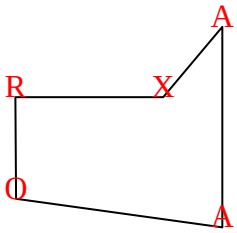


## Respuestas

| | | | | |
|---|---|---|---|---|
| Ej. | 2 | 1 | 2 | 2 |
| 1. | 5 | 0 | 0 | 5 |
| 2. | 0 | 3 | 2 | 0 |
| 3. | 4 | 0 | 0 | 3 |
| 4. | 0 | 0 | 6 | 0 |
| 5. | 0 | 0 | 8 | 4 |
| 6. | 1 | 2 | 1 | 0 |
| 7. | 3 | 0 | 0 | 0 |
| 8. | 4 | 2 | 0 | 4 |
| 9. | 2 | 2 | 1 | 2 |
| 10. | 0 | 2 | 3 | 0 |
| 11. | 2 | 1 | 1 | 1 |