Encontrando la distancia en una cuadrícula

Nombre:

Encuentra la distancia entre puntos. Redondea tu respuesta al decimal más cercano.

Ej)

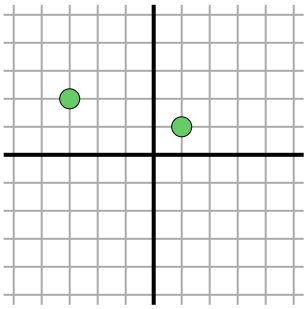

$\sqrt{(-3-1)^2 + (2-1)^2}$

$\sqrt{(16) + (1)}$

1)

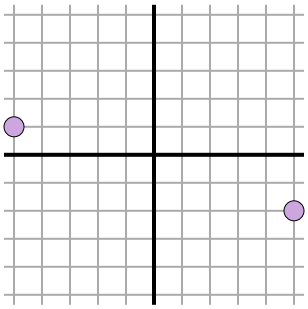

2)

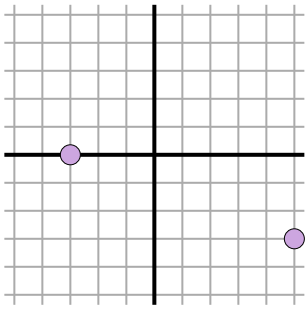

3)

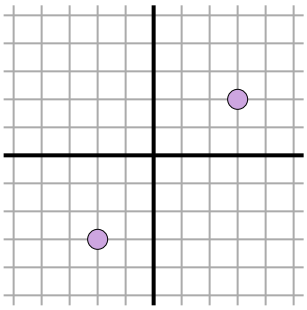

4)

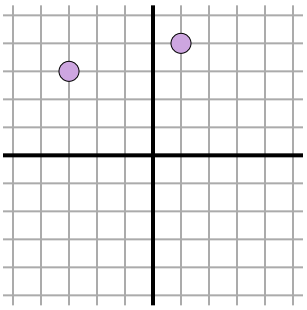

5)

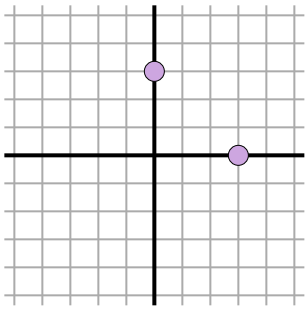

6)

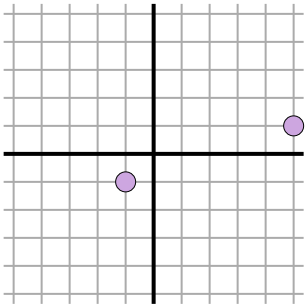

7)

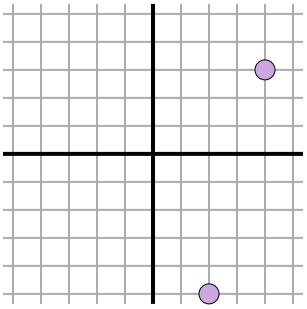

8)

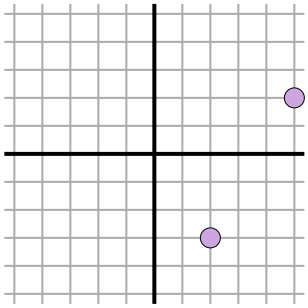

9)

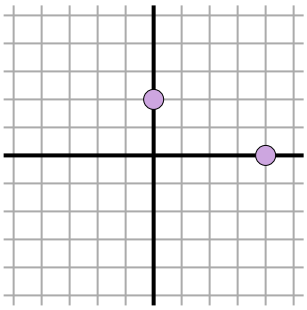

10)

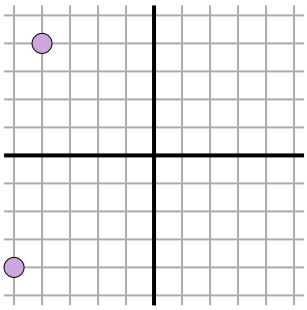

11)

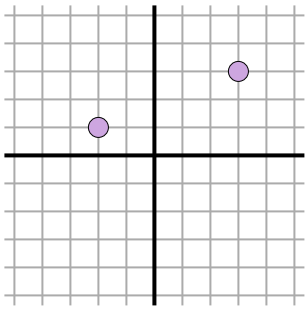

Respuestas

Ej. 4.1

1. _____
2. _____
3. _____
4. _____
5. _____
6. _____
7. _____
8. _____
9. _____
10. _____
11. _____

1-10	91	82	73	64	55	45	36	27	18	9
11	0									

Encontrando la distancia en una cuadrícula

Nombre: **Clave De Respuestas**

Encuentra la distancia entre puntos. Redondea tu respuesta al decimal más cercano.

Ej)

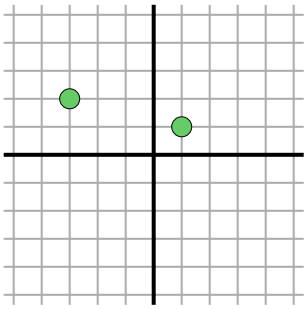

$\sqrt{(-3-1)^2 + (2-1)^2}$

$\sqrt{(16) + (1)}$

1)

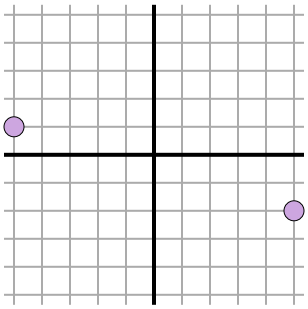

$\sqrt{(5--5)^2 + (-2-1)^2}$

$\sqrt{(100) + (9)}$

2)

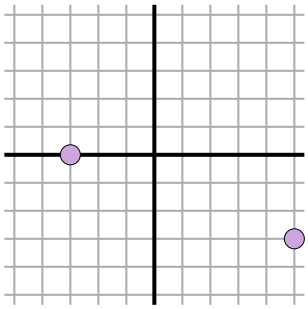

$\sqrt{(-3-5)^2 + (0--3)^2}$

$\sqrt{(64) + (9)}$

3)

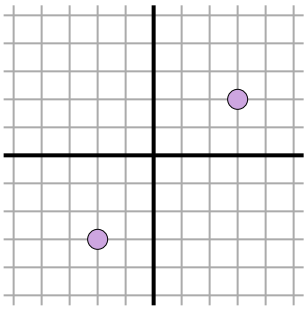

$\sqrt{(3--2)^2 + (2--3)^2}$

$\sqrt{(25) + (25)}$

4)

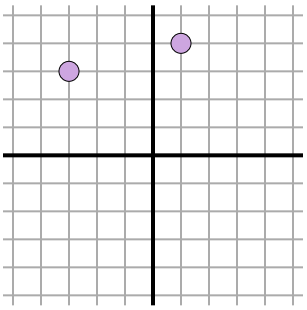

$\sqrt{(-3-1)^2 + (3-4)^2}$

$\sqrt{(16) + (1)}$

5)

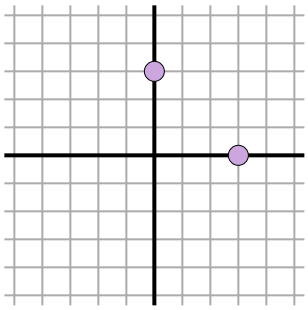

$\sqrt{(3-0)^2 + (0-3)^2}$

$\sqrt{(9) + (9)}$

6)

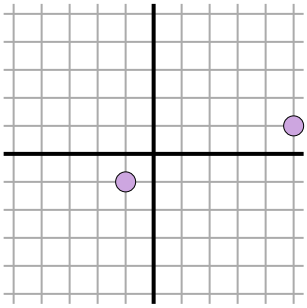

$\sqrt{(5--1)^2 + (1--1)^2}$

$\sqrt{(36) + (4)}$

7)

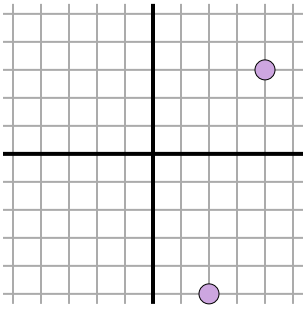

$\sqrt{(4-2)^2 + (3--5)^2}$

$\sqrt{(4) + (64)}$

8)

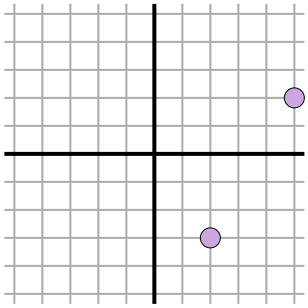

$\sqrt{(5-2)^2 + (2--3)^2}$

$\sqrt{(9) + (25)}$

9)

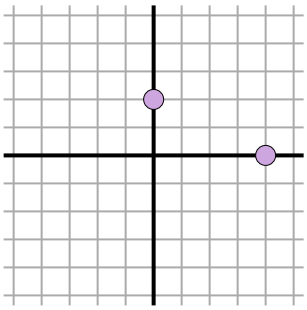

$\sqrt{(0-4)^2 + (2-0)^2}$

$\sqrt{(16) + (4)}$

10)

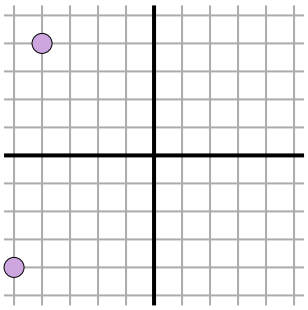

$\sqrt{(-4--5)^2 + (4--4)^2}$

$\sqrt{(1) + (64)}$

11)

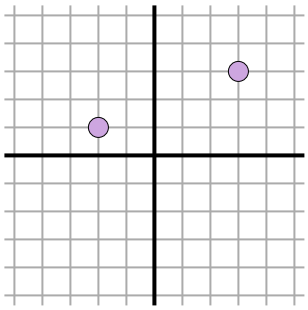

$\sqrt{(-2-3)^2 + (1-3)^2}$

$\sqrt{(25) + (4)}$

Respuestas

Ej.	4.1
1.	10.4
2.	8.5
3.	7.1
4.	4.1
5.	4.2
6.	6.3
7.	8.2
8.	5.8
9.	4.5
10.	8.1
11.	5.4