Contando figuras Nombre:

Cuenta el número de figuras en cada caja.



Ej) = 3

1) = _____

2) = _____

3) = _____



4) = _____

5) = _____

6) = _____

7) = _____



8) = _____

9) = _____

10) = _____

11) = _____

1-10	91	82	73	64	55	45	36	27	18	9
11	0									

Contando figuras

Nombre: **Clave De Respuestas**

Cuenta el número de figuras en cada caja.



Ej) = 3

1) = 1

2) = 7

3) = 5

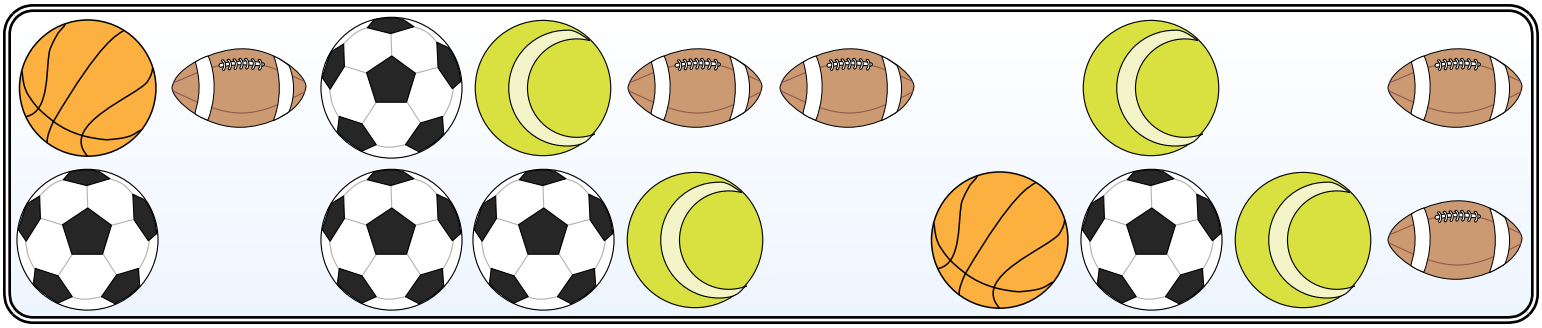

4) = 2

5) = 5

6) = 5

7) = 4



8) = 4

9) = 6

10) = 5

11) = 4

1-10	91	82	73	64	55	45	36	27	18	9
11	0									