Emparejando Relojes

Nombre:

Emparejar el reloj analógico con el reloj digital correspondiente.

1) 

2) 

3) 

4) 

5) 

6) 

7) 

8) 

9) 

10) 

11) 

12) 

13) 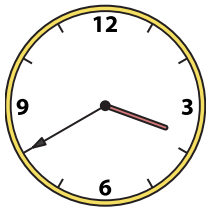

14) 

15) 

16) 

A. 3:40 **B.** 9:10 **C.** 12:20 **D.** 12:15

E. 12:00 **F.** 12:15 **G.** 10:45 **H.** 12:50

I. 8:15 **J.** 11:20 **K.** 5:15 **L.** 1:45

M. 12:30 **N.** 4:15 **O.** 3:30 **P.** 3:15

Respuestas

1. _____
2. _____
3. _____
4. _____
5. _____
6. _____
7. _____
8. _____
9. _____
10. _____
11. _____
12. _____
13. _____
14. _____
15. _____
16. _____

1-10	94	88	81	75	69	63	56	50	44	38
11-16	31	25	19	13	6	0				

Nombre: **Clave De Respuestas**

Emparejar el reloj analógico con el reloj digital correspondiente.

1) 
2) 
3) 
4) 

5) 
6) 
7) 
8) 

9) 
10) 
11) 
12) 

13) 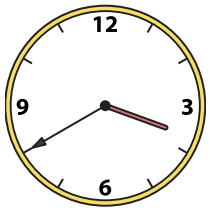
14) 
15) 
16) 

A. 3:40
B. 9:10
C. 12:20
D. 12:15
E. 12:00
F. 12:15
G. 10:45
H. 12:50
I. 8:15
J. 11:20
K. 5:15
L. 1:45
M. 12:30
N. 4:15
O. 3:30
P. 3:15

Respuestas

1. I
2. D
3. M
4. G
5. L
6. P
7. K
8. J
9. F
10. N
11. C
12. E
13. A
14. B
15. H
16. O

1-10	94	88	81	75	69	63	56	50	44	38
11-16	31	25	19	13	6	0				