Creación de relojes Nombre:

Dibuje la manecilla de las horas y los minutos en el reloj para que represente la hora mostrada.

1) 12:14

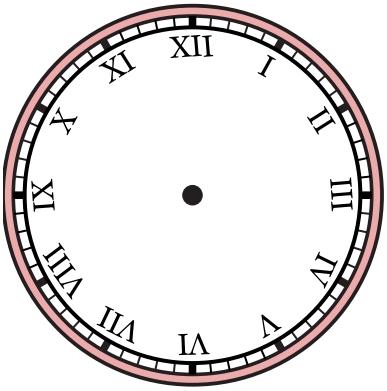

2) 9:35

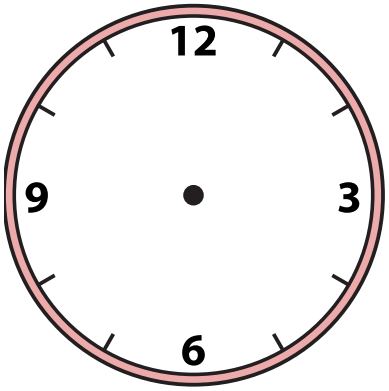

3) 8:53

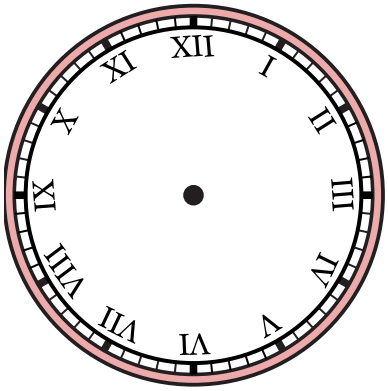

4) 2:53

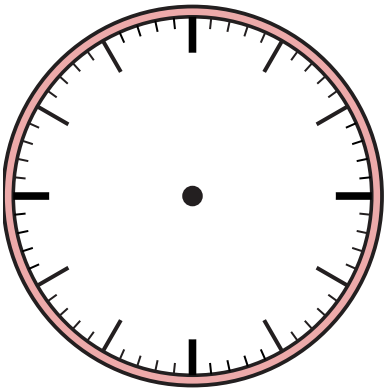

5) 10:59

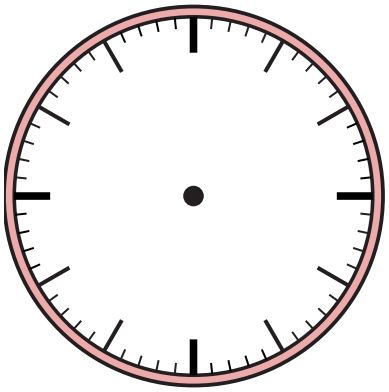

6) 4:43

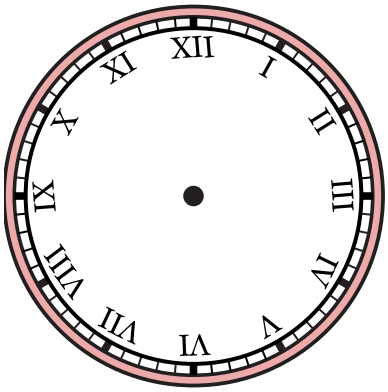

7) 5:53

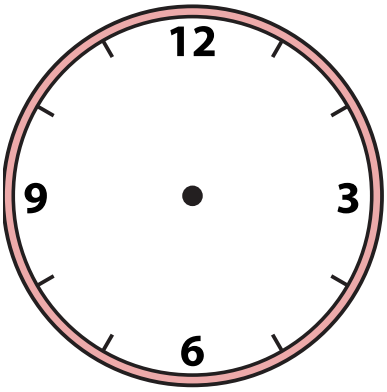

8) 11:39

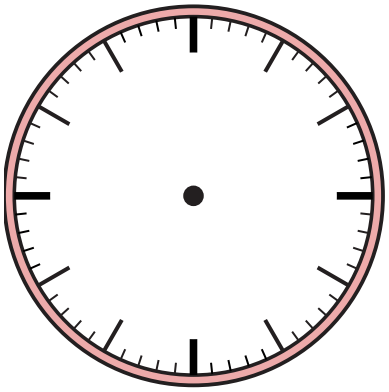

9) 9:46

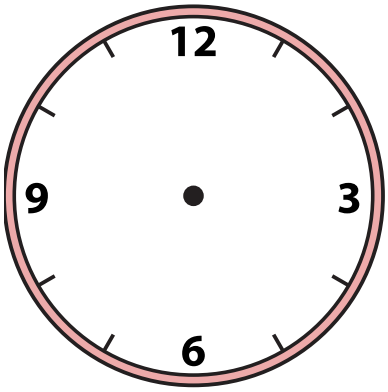

1-9	89	78	67	56	44	33	22	11	0

Dibuje la manecilla de las horas y los minutos en el reloj para que represente la hora mostrada.

1) 12:14



2) 9:35



3) 8:53

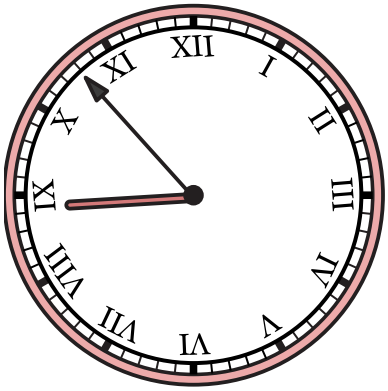

4) 2:53

5) 10:59

6) 4:43

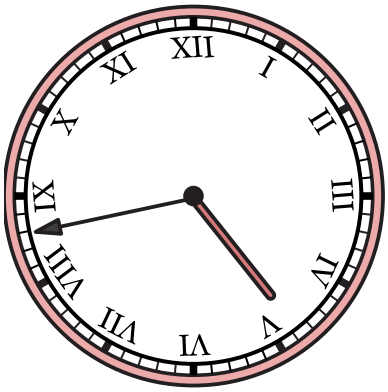

7) 5:53



8) 11:39

9) 9:46



1-9	89	78	67	56	44	33	22	11	0