Determinación de la simetría

Nombre:

Determinar si la línea a través de cada figura es una línea de simetría.

Ej)

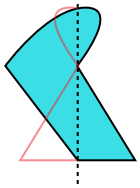

1)

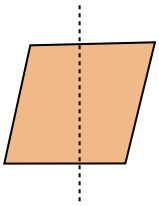

2)

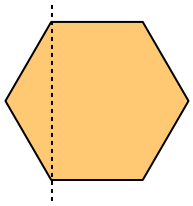

3)

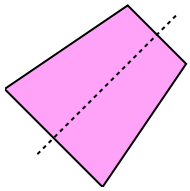

4)

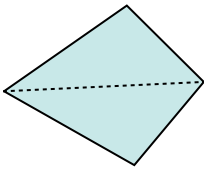

5)

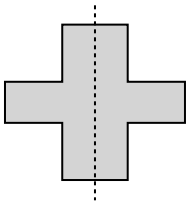

6)

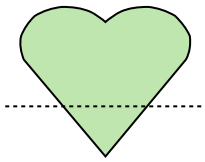

7)

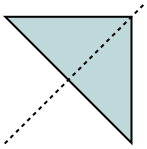

8)

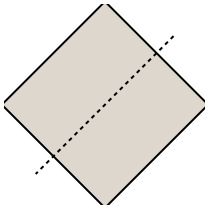

9)

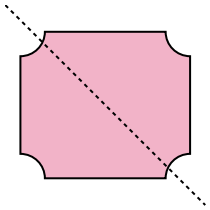

10)

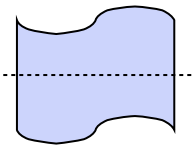

11)

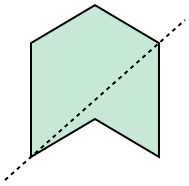

Respuestas

Ej. no

1. _____

2. _____

3. _____

4. _____

5. _____

6. _____

7. _____

8. _____

9. _____

10. _____

11. _____

1-10	91	82	73	64	55	45	36	27	18	9
11	0									

Determinación de la simetría

Nombre: **Clave De Respuestas**

Determinar si la línea a través de cada figura es una línea de simetría.

Ej)

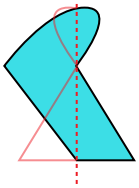

1)

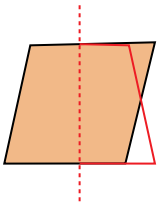

2)

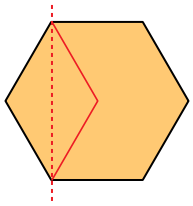

3)

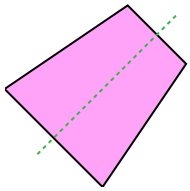

4)

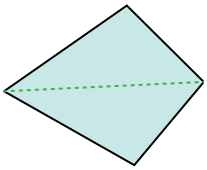

5)

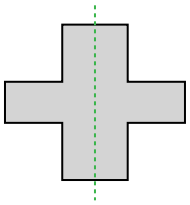

6)

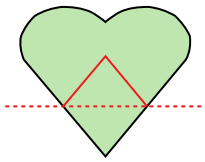

7)

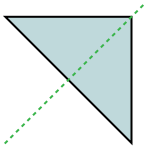

8)

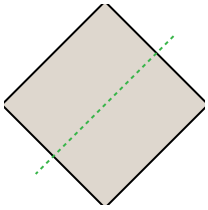

9)

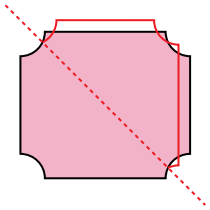

10)

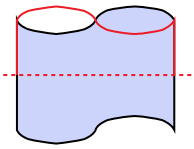

11)

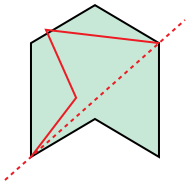

Respuestas

Ej.	no
1.	no
2.	no
3.	si
4.	si
5.	si
6.	no
7.	si
8.	si
9.	no
10.	no
11.	no

1-10	91	82	73	64	55	45	36	27	18	9
11	0									