Identificando Figuras

Nombre:

Determinar si la forma mostrada es un 'Triángulo', 'Cuadrado', 'Rectángulo', 'Hexágono' u 'Otro'.

1)

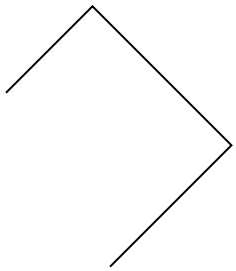

2)

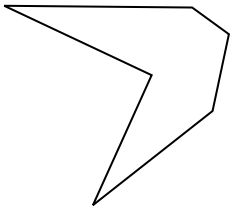

3)



4)

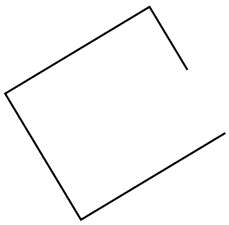

5)

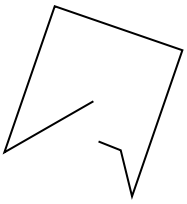

6)

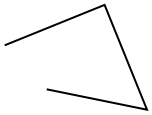

7)

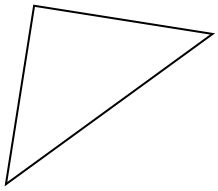

8)

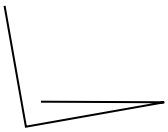

9)



10)

11)

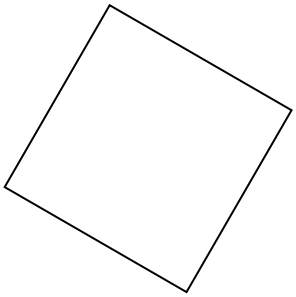

12)

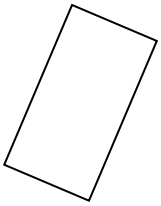

13)

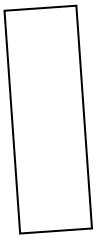

14)

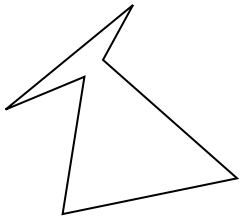

15)

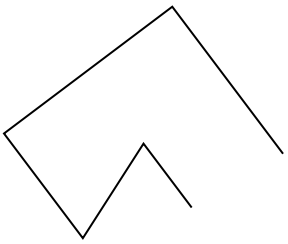

Respuestas

1. _____
2. _____
3. _____
4. _____
5. _____
6. _____
7. _____
8. _____
9. _____
10. _____
11. _____
12. _____
13. _____
14. _____
15. _____

1-10	93	87	80	73	67	60	53	47	40	33
11-15	27	20	13	7	0					

Determinar si la forma mostrada es un 'Triángulo', 'Cuadrado', 'Rectángulo', 'Hexágono' u 'Otro'.

1)

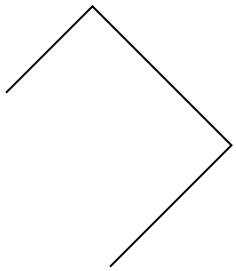

2)

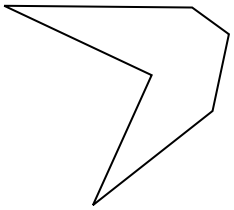

3)



4)

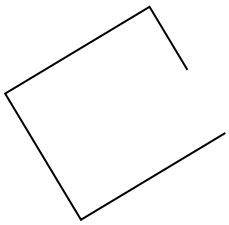

5)

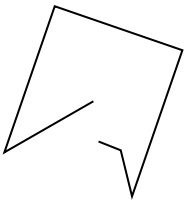

6)

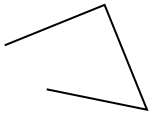

7)

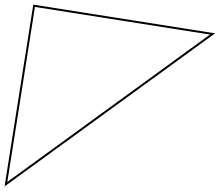

8)

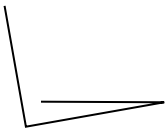

9)



10)

11)

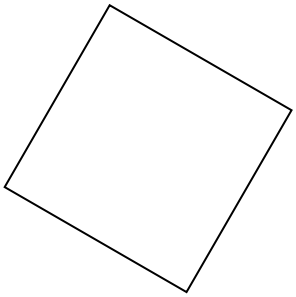

12)

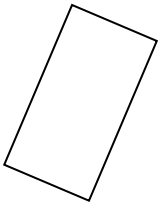

13)

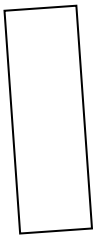

14)

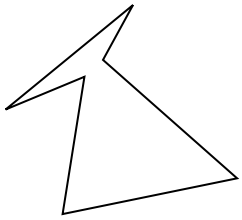

15)

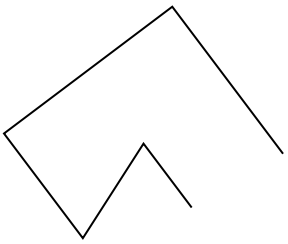

Respuestas

1. Otra
2. hexágono
3. rectangle
4. Otra
5. Otra
6. Otra
7. triangle
8. Otra
9. hexágono
10. triangle
11. square
12. rectangle
13. rectangle
14. hexágono
15. Otra

1-10	93	87	80	73	67	60	53	47	40	33
11-15	27	20	13	7	0					