Emparejando Desigualdades a Líneas de Números

Nombre:

Resuelve cada problema.

1) ¿Qué opción representa mejor X < 20

A.

B. 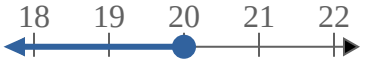

C.

D.

2) ¿Qué opción representa mejor X ≥ -5

A.

B.

C.

D.

3) ¿Qué opción representa mejor X ≤ -8

A. 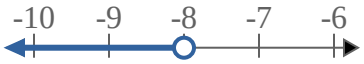

B.

C. 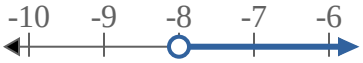

D. 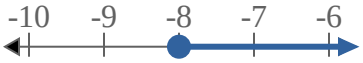

4) ¿Qué opción representa mejor X ≥ 6

A.

B. 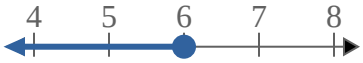

C.

D. 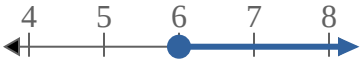

5) ¿Qué opción representa mejor X > -1

A.

B.

C.

D.

6) ¿Qué opción representa mejor X ≤ 6

A.

B. 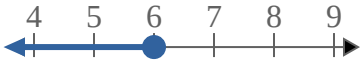

C.

D.

7) ¿Qué opción representa mejor X < 9

A.

B.

C.

D.

8) ¿Qué opción representa mejor X ≤ -11

A.

B.

C. 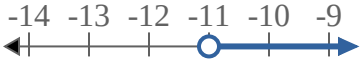

D. 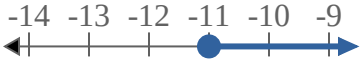

Respuestas

1. _____
2. _____
3. _____
4. _____
5. _____
6. _____
7. _____
8. _____

1-8	88	75	63	50	38	25	13	0

Resuelve cada problema.

1) ¿Qué opción representa mejor X < 20

A.

B. 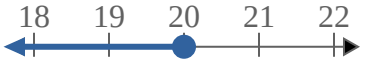

C.

D.

2) ¿Qué opción representa mejor X ≥ -5

A.

B.

C.

D.

3) ¿Qué opción representa mejor X ≤ -8

A. 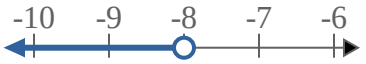

B. 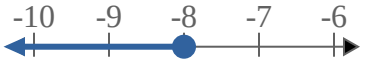

C. 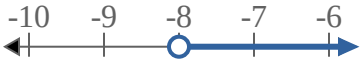

D. 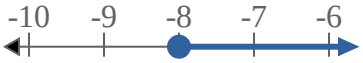

4) ¿Qué opción representa mejor X ≥ 6

A.

B. 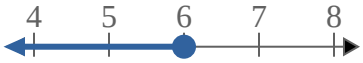

C.

D. 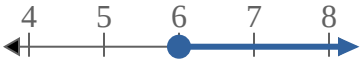

5) ¿Qué opción representa mejor X > -1

A.

B.

C.

D.

6) ¿Qué opción representa mejor X ≤ 6

A.

B. 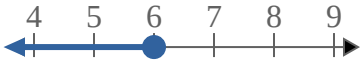

C.

D.

7) ¿Qué opción representa mejor X < 9

A. 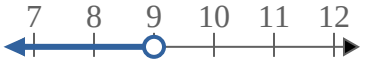

B.

C.

D.

8) ¿Qué opción representa mejor X ≤ -11

A.

B.

C. 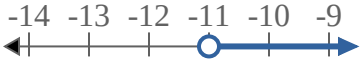

D. 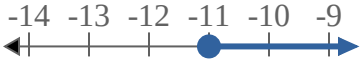

Respuestas

1. **A**
2. **D**
3. **B**
4. **D**
5. **C**
6. **B**
7. **A**
8. **B**

1-8	88	75	63	50	38	25	13	0