Máquinas de Funciones - (Sumar y Restar) Nombre:

**Determina la regla que cada máquina de función está usando.**

**Ej)**

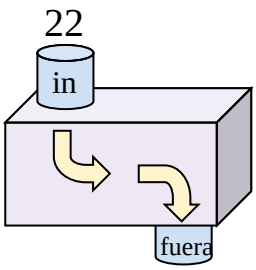


Agregar 20

**1)**

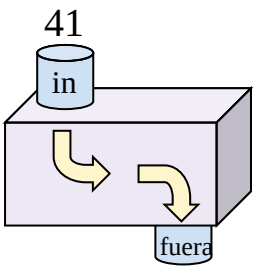


**2)**

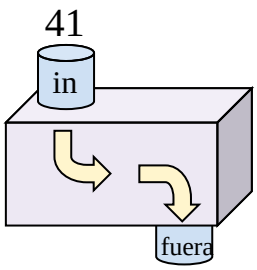


**3)**

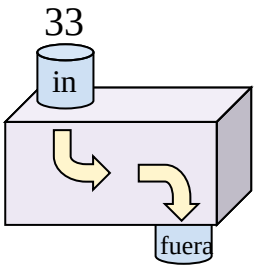


**4)**

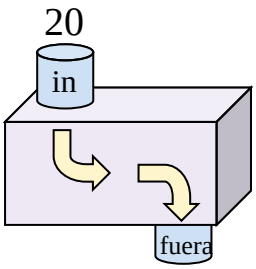


**5)**

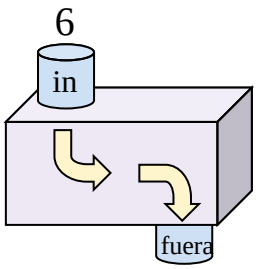


**6)**

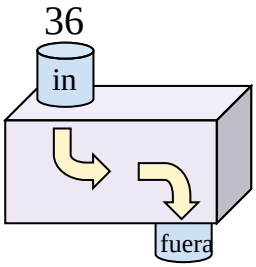


**7)**

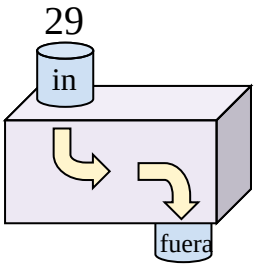


**8)**

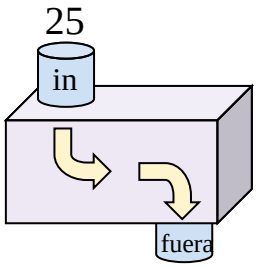


**9)**

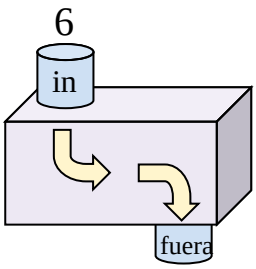


**10)**

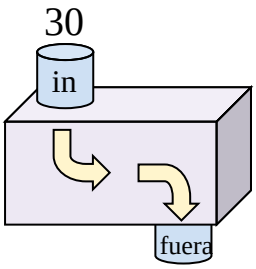


**11)**

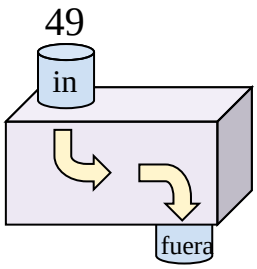


## Respuestas

Ej. Agregar 20

1. _____
2. _____
3. _____
4. _____
5. _____
6. _____
7. _____
8. _____
9. _____
10. _____
11. _____



| | | | | | | | | | | |
|---|---|---|---|---|---|---|---|---|---|---|
| 1-10 | 91 | 82 | 73 | 64 | 55 | 45 | 36 | 27 | 18 | 9 |
| 11 | 0 | | | | | | | | | |

**Determina la regla que cada máquina de función está usando.**

**Ej)**

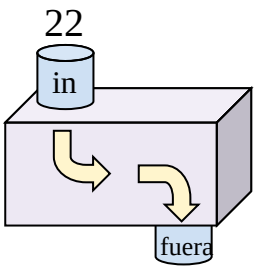


Agregar 20

**1)**

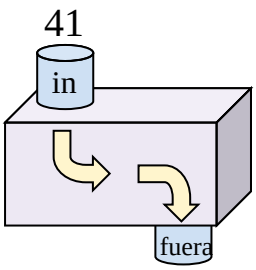


Restar 18

**2)**

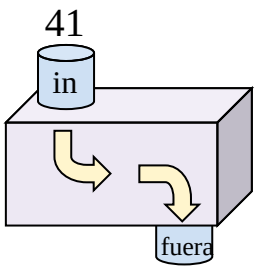


Restar 33

**3)**

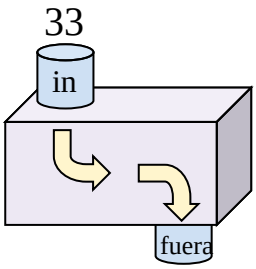


Restar 16

**4)**

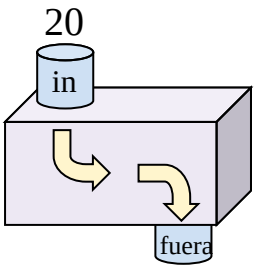


Restar 8

**5)**

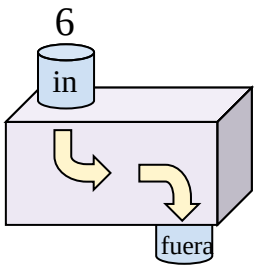


Agregar 37

**6)**

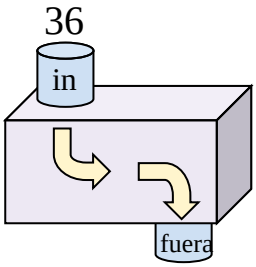


Restar 11

**7)**

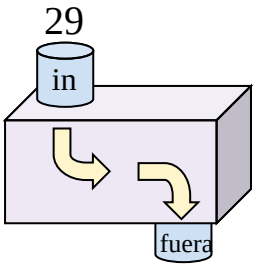


Agregar 15

**8)**

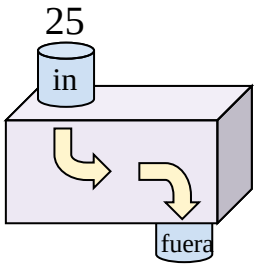


Agregar 25

**9)**

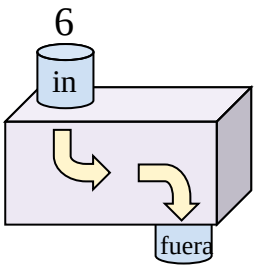


Agregar 10

**10)**

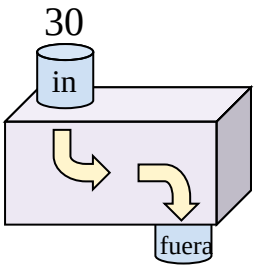


Restar 16

**11)**

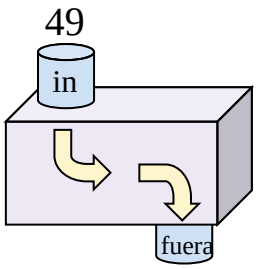


Restar 29

## Respuestas

Ej. **Agregar 20**

1. **Restar 18**
2. **Restar 33**
3. **Restar 16**
4. **Restar 8**
5. **Agregar 37**
6. **Restar 11**
7. **Agregar 15**
8. **Agregar 25**
9. **Agregar 10**
10. **Restar 16**
11. **Restar 29**



| | | | | | | | | | | |
|---|---|---|---|---|---|---|---|---|---|---|
| 1-10 | 91 | 82 | 73 | 64 | 55 | 45 | 36 | 27 | 18 | 9 |
| 11 | 0 | | | | | | | | | |