Máquinas de Funciones - (Sumar y Restar) Nombre:

Determina la regla que cada máquina de función está usando.

Ej)

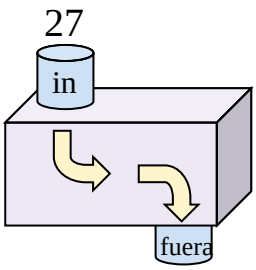

Restar 5

1)

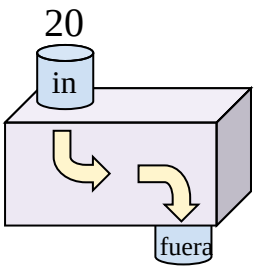

2)

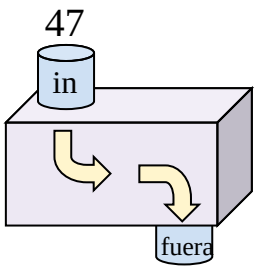

3)

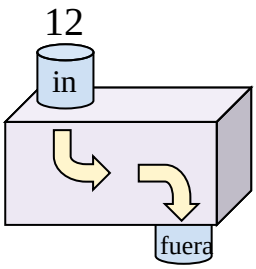

4)

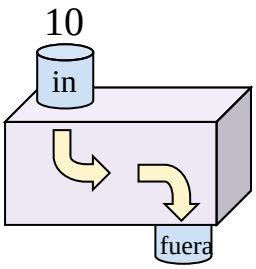

5)

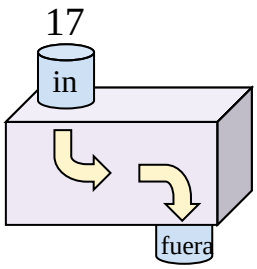

6)

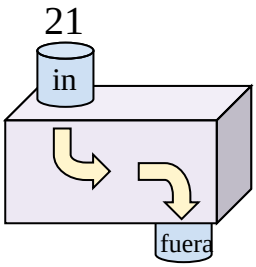

7)

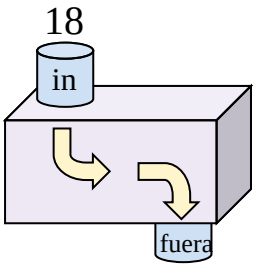

8)

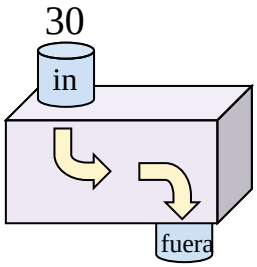

9)

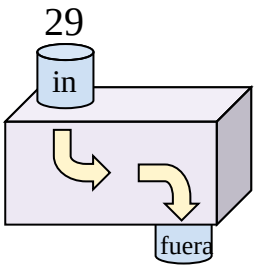

10)

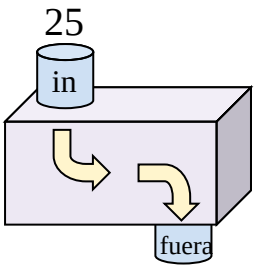

11)

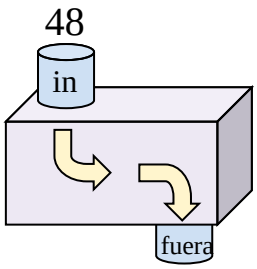

Respuestas

Ej. Restar 5

1. _____
2. _____
3. _____
4. _____
5. _____
6. _____
7. _____
8. _____
9. _____
10. _____
11. _____

1-10	91	82	73	64	55	45	36	27	18	9
11	0									

Determina la regla que cada máquina de función está usando.

Ej)

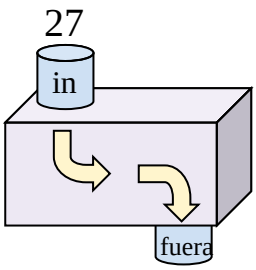

Restar 5

1)

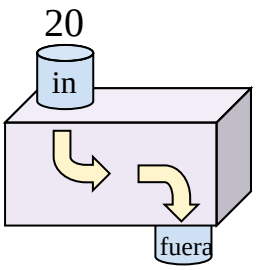

Agregar 14

2)

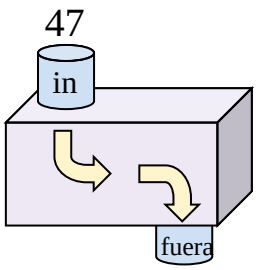

Restar 33

3)

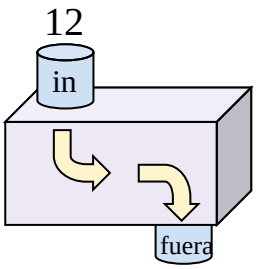

Agregar 27

4)

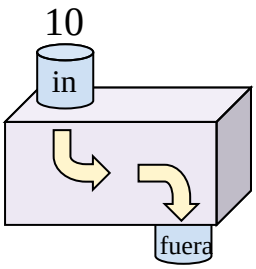

Agregar 30

5)

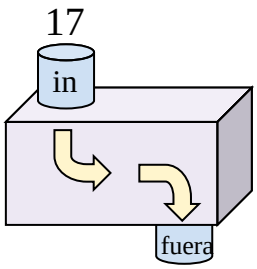

Agregar 25

6)

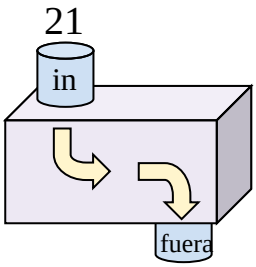

Agregar 24

7)

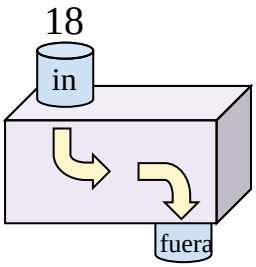

Restar 12

8)

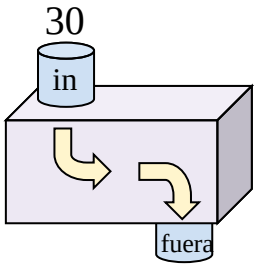

Restar 6

9)

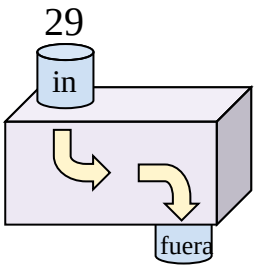

Agregar 18

10)

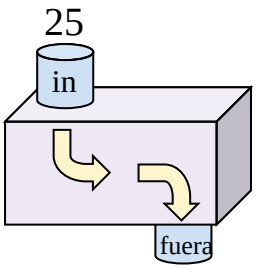

Agregar 5

11)

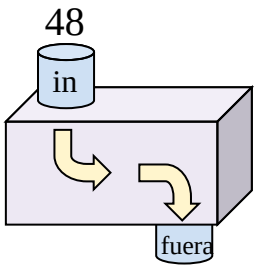

Restar 31

Respuestas

Ej. **Restar 5**

1. **Agregar 14**
2. **Restar 33**
3. **Agregar 27**
4. **Agregar 30**
5. **Agregar 25**
6. **Agregar 24**
7. **Restar 12**
8. **Restar 6**
9. **Agregar 18**
10. **Agregar 5**
11. **Restar 31**

1-10	91	82	73	64	55	45	36	27	18	9
11	0									