Ubicación del Número negativo en la Recta Numérica Nombre:

Resuelve cada problema.

1) ¿Qué letra representa mejor -29

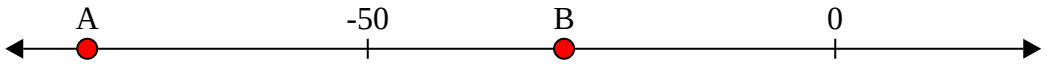

2) ¿Qué letra representa mejor -120



3) ¿Qué letra representa mejor -118



4) ¿Qué letra representa mejor -14



5) ¿Qué letra representa mejor -109



6) ¿Qué letra representa mejor -28



7) ¿Qué letra representa mejor -21



8) ¿Qué letra representa mejor -14



9) ¿Qué letra representa mejor -13



10) ¿Qué letra representa mejor -114



Respuestas

1. _____
2. _____
3. _____
4. _____
5. _____
6. _____
7. _____
8. _____
9. _____
10. _____

1-10	90	80	70	60	50	40	30	20	10	0

Resuelve cada problema.

1) ¿Qué letra representa mejor -29

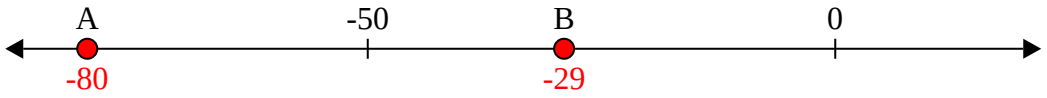

2) ¿Qué letra representa mejor -120

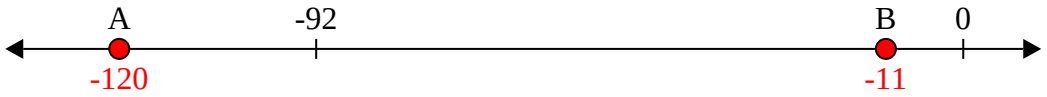

3) ¿Qué letra representa mejor -118

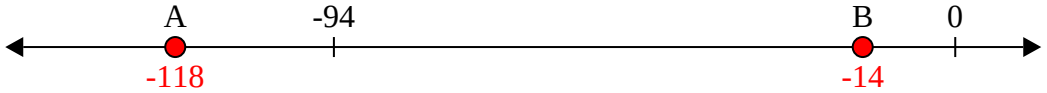

4) ¿Qué letra representa mejor -14

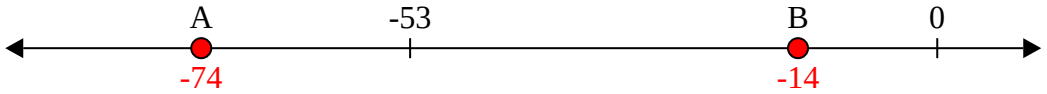

5) ¿Qué letra representa mejor -109

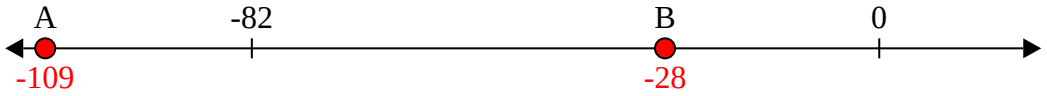

6) ¿Qué letra representa mejor -28

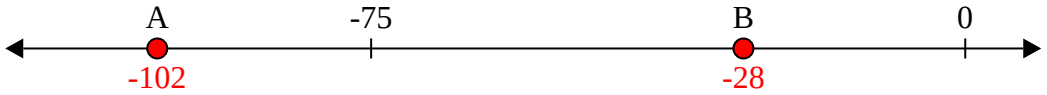

7) ¿Qué letra representa mejor -21

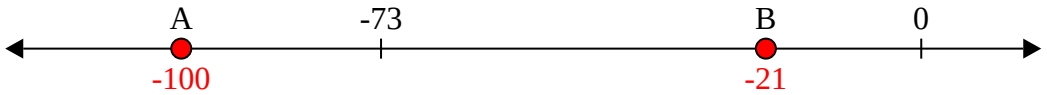

8) ¿Qué letra representa mejor -14

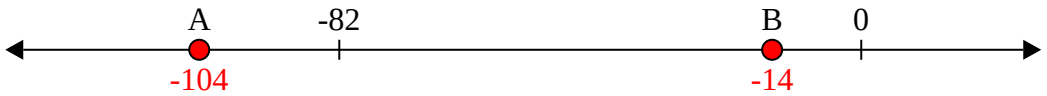

9) ¿Qué letra representa mejor -13

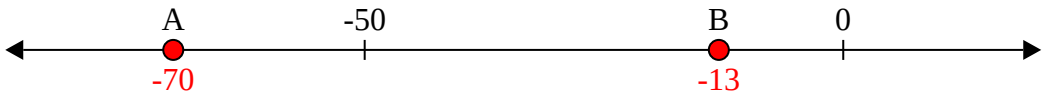

10) ¿Qué letra representa mejor -114

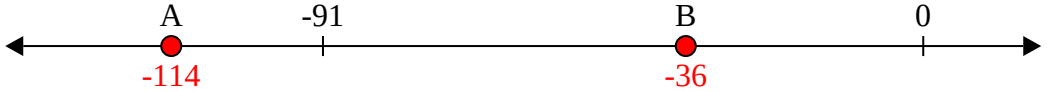

Respuestas

1. **B**
2. **A**
3. **A**
4. **B**
5. **A**
6. **B**
7. **B**
8. **B**
9. **B**
10. **A**

1-10	90	80	70	60	50	40	30	20	10	0