Medir el ancho y alto de cada bloque en pulgadas y en centímetros

Ej)

1)

2)



3)



4)



Respuestas

Ej.	3	0 ½	7.6	1.3
1.				
2.				
3.				
4.				

1-4	75	50	25	0

Medir el ancho y alto de cada bloque en pulgadas y en centímetros

Ej)

1)

2)



3)



4)



Respuestas

Ej.	3	0 1/2	7.6	1.3
1.	1 1/2	1	3.8	2.5
2.	0 1/2	1	1.3	2.5
3.	5 1/2	1	14	2.5
4.	1	1 1/2	2.5	3.8

1-4	75	50	25	0