Encontrando la distancia en el plano cartesiano Nombre:

Encuentra la distancia entre puntos. Redondea tu respuesta al decimal más cercano.

Ej)

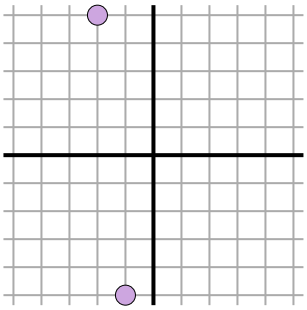

1)

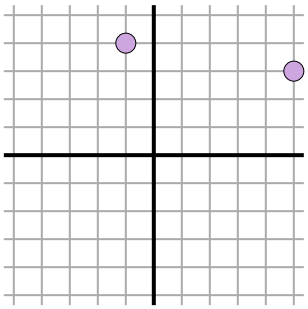

2)

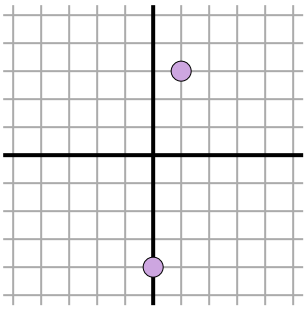

3)

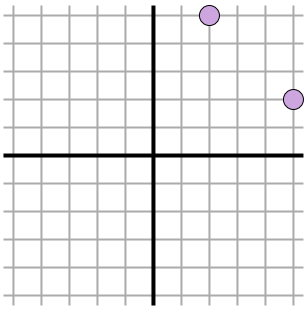

4)

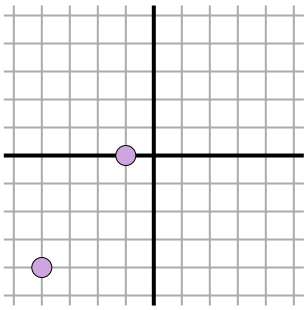

5)

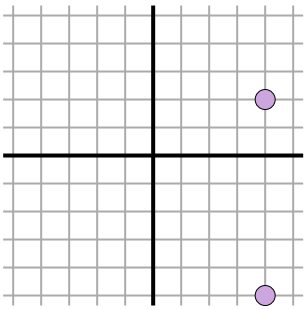

6)

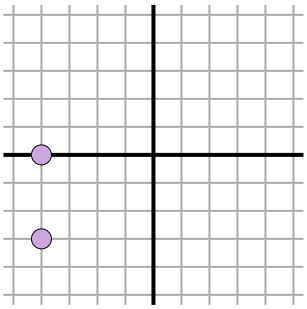

7)

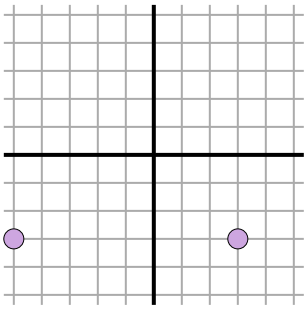

8)

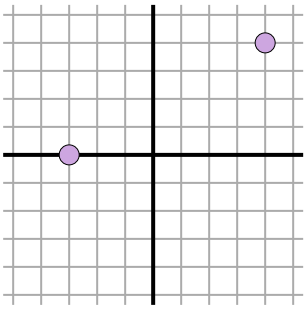

9)

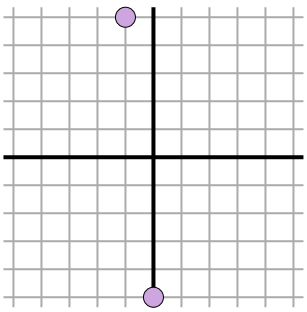

10)

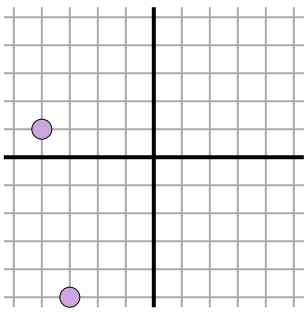

11)

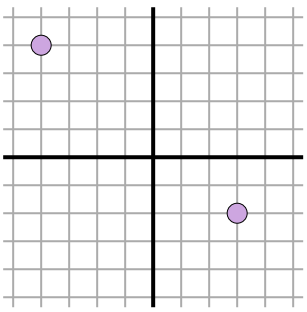

Respuestas

Ej. 10

1. _____
2. _____
3. _____
4. _____
5. _____
6. _____
7. _____
8. _____
9. _____
10. _____
11. _____

1-10	91	82	73	64	55	45	36	27	18	9
11	0									

Encuentra la distancia entre puntos. Redondea tu respuesta al decimal más cercano.

Ej)

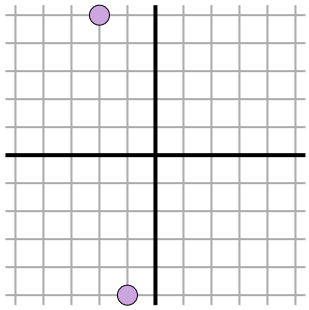

$\sqrt{(-2--1)^2 + (5--5)^2}$

$\sqrt{(1) + (100)}$

1)

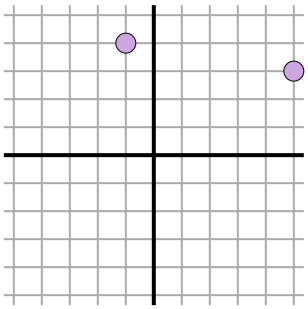

$\sqrt{(5--1)^2 + (3-4)^2}$

$\sqrt{(36) + (1)}$

2)

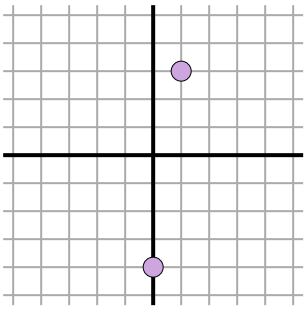

$\sqrt{(1-0)^2 + (3--4)^2}$

$\sqrt{(1) + (49)}$

3)

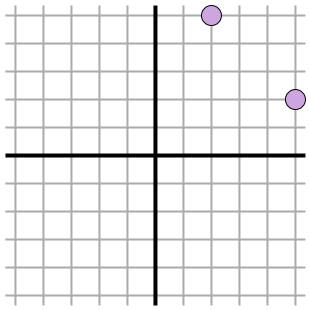

$\sqrt{(5-2)^2 + (2-5)^2}$

$\sqrt{(9) + (9)}$

4)

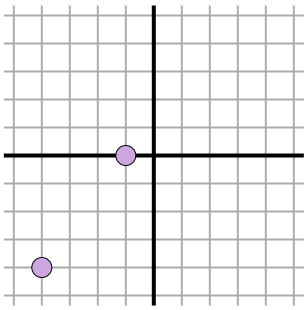

$\sqrt{(-4--1)^2 + (-4-0)^2}$

$\sqrt{(9) + (16)}$

5)

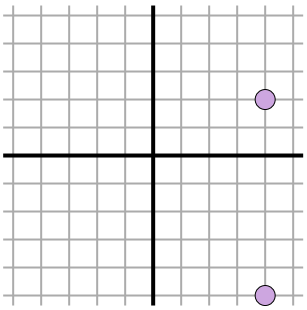

$\sqrt{(4-4)^2 + (-5-2)^2}$

$\sqrt{(0) + (49)}$

6)

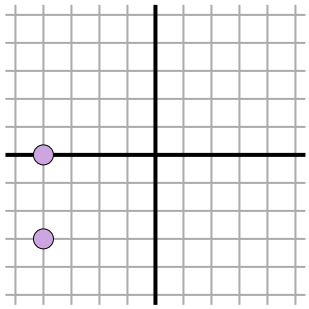

$\sqrt{(-4--4)^2 + (0--3)^2}$

$\sqrt{(0) + (9)}$

7)

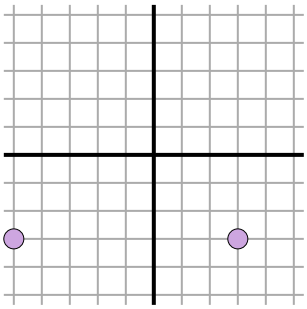

$\sqrt{(-5-3)^2 + (-3--3)^2}$

$\sqrt{(64) + (0)}$

8)

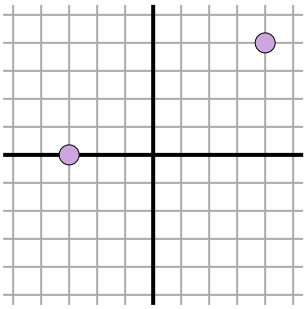

$\sqrt{(4--3)^2 + (4-0)^2}$

$\sqrt{(49) + (16)}$

9)

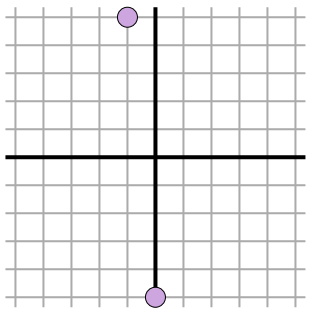

$\sqrt{(-1-0)^2 + (5--5)^2}$

$\sqrt{(1) + (100)}$

10)

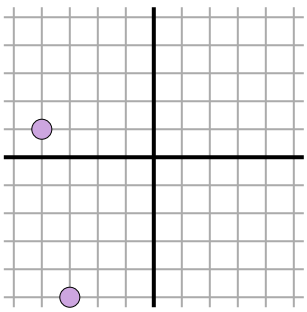

$\sqrt{(-4--3)^2 + (1--5)^2}$

$\sqrt{(1) + (36)}$

11)

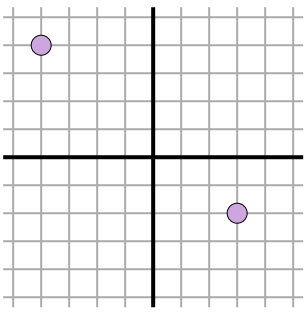

$\sqrt{(-4-3)^2 + (4--2)^2}$

$\sqrt{(49) + (36)}$

Respuestas

Ej.	10
1.	6.1
2.	7.1
3.	4.2
4.	5
5.	7
6.	3
7.	8
8.	8.1
9.	10
10.	6.1
11.	9.2

1-10	91	82	73	64	55	45	36	27	18	9
11	0									