Dividiendo con una recta numérica Nombre:

Usa las rectas numéricas para resolver los problemas.

1) 9÷3=

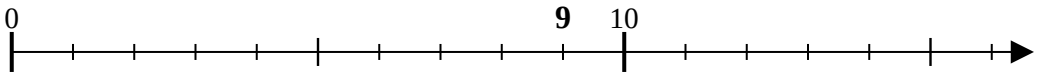

2) 6÷2=

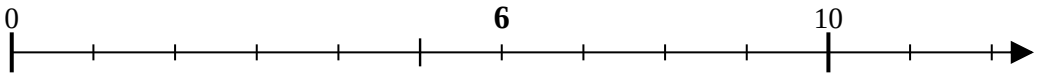

3) 12÷4=

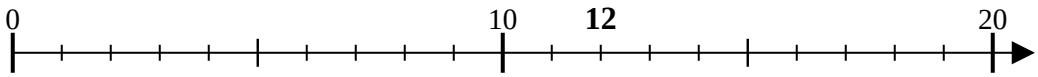

4) 15÷5=

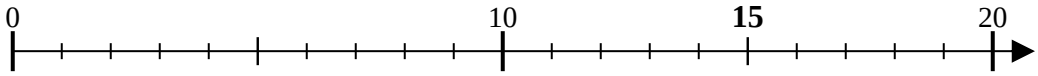

5) 28÷7=

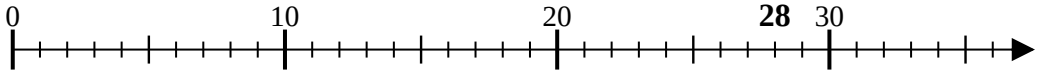

6) 40÷10=

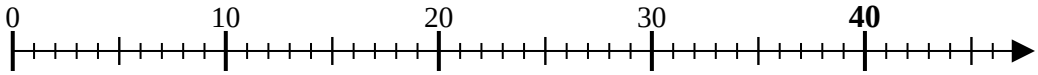

7) 24÷6=

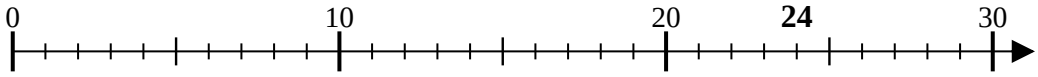

8) 30÷10=

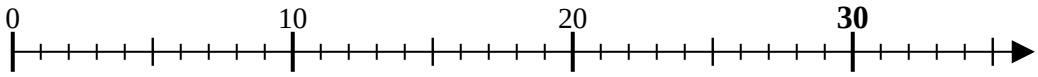

9) 30÷6=

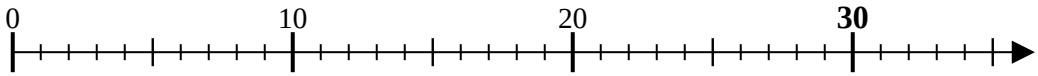

10) 12÷3=

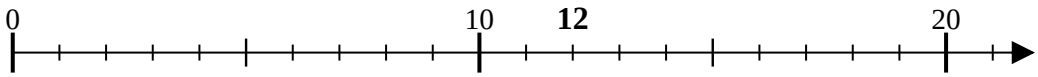

11) 18÷6=

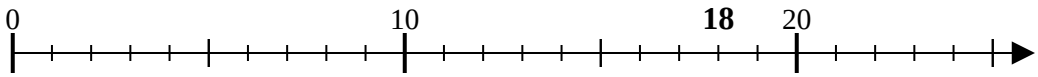

Respuestas

1. _____
2. _____
3. _____
4. _____
5. _____
6. _____
7. _____
8. _____
9. _____
10. _____
11. _____

1-10	91	82	73	64	55	45	36	27	18	9
11	0									

Usa las rectas numéricas para resolver los problemas.

1) 9÷3=

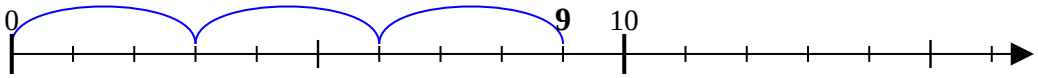

2) 6÷2=

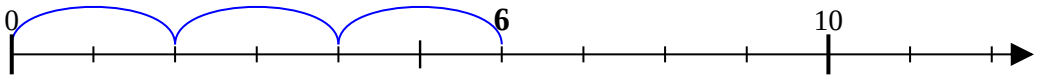

3) 12÷4=

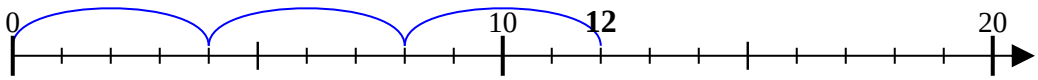

4) 15÷5=

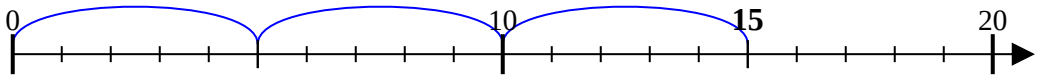

5) 28÷7=

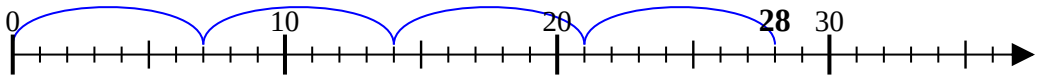

6) 40÷10=

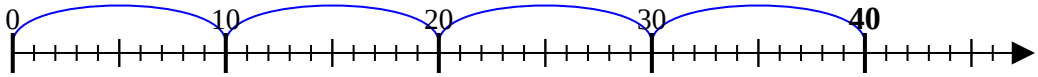

7) 24÷6=

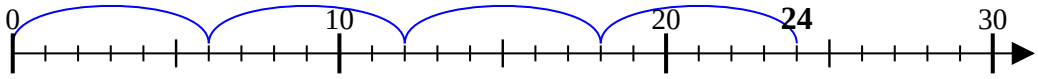

8) 30÷10=

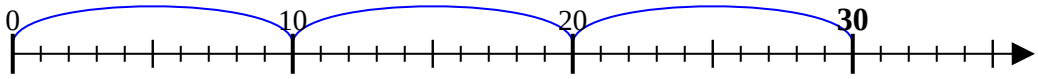

9) 30÷6=

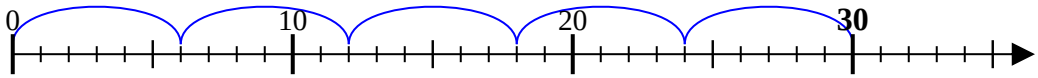

10) 12÷3=

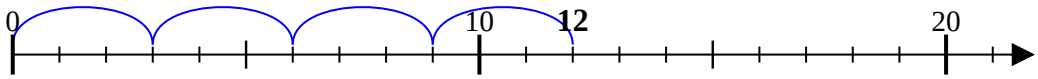

11) 18÷6=

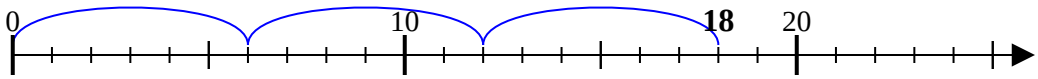

Respuestas

1. 3
2. 3
3. 3
4. 3
5. 4
6. 4
7. 4
8. 3
9. 5
10. 4
11. 3

1-10	91	82	73	64	55	45	36	27	18	9
11	0									

Dividiendo con una recta numérica Nombre:

Usa las rectas numéricas para resolver los problemas.

1) 15÷5=

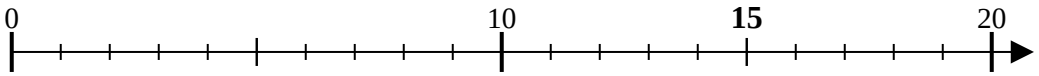

2) 16÷8=

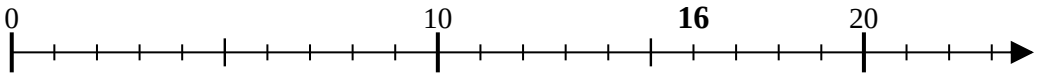

3) 8÷2=

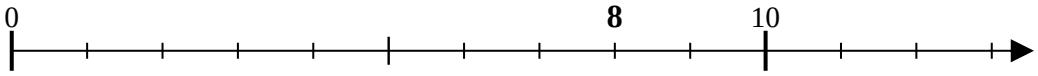

4) 36÷9=

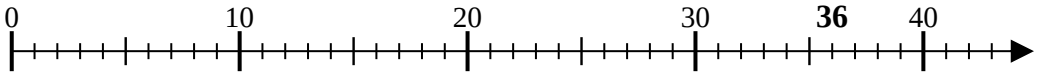

5) 10÷5=

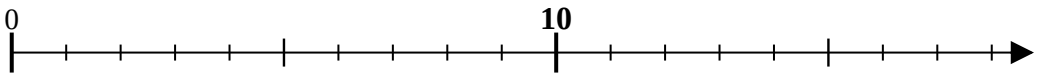

6) 16÷4=

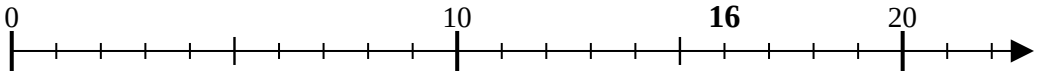

7) 6÷2=

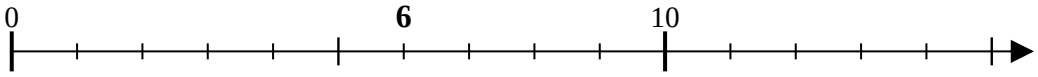

8) 12÷6=

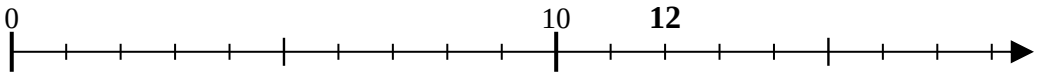

9) 6÷3=

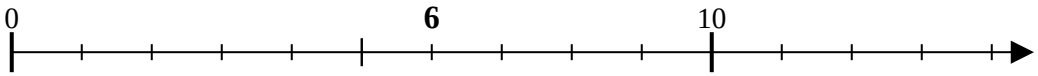

10) 18÷9=

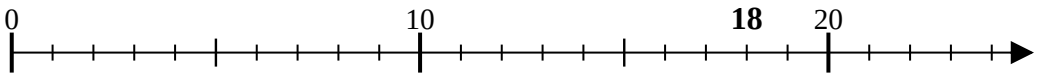

11) 45÷9=

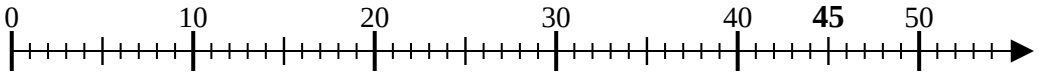

Respuestas

1. _____
2. _____
3. _____
4. _____
5. _____
6. _____
7. _____
8. _____
9. _____
10. _____
11. _____

1-10	91	82	73	64	55	45	36	27	18	9
11	0									

Usa las rectas numéricas para resolver los problemas.

1) 15÷5=

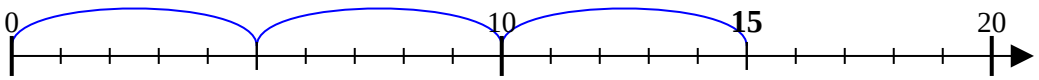

2) 16÷8=

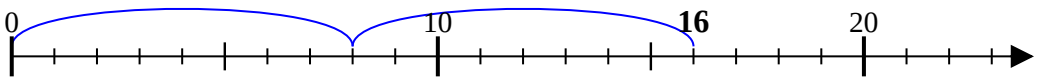

3) 8÷2=

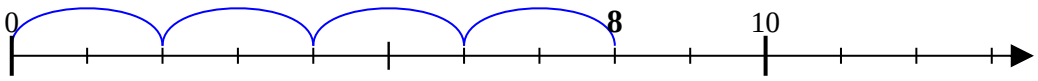

4) 36÷9=

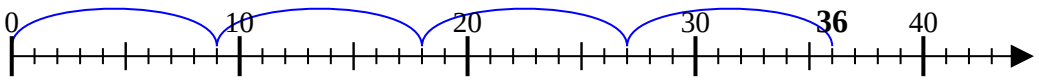

5) 10÷5=

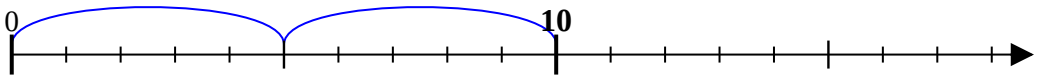

6) 16÷4=

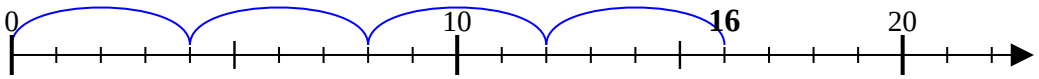

7) 6÷2=

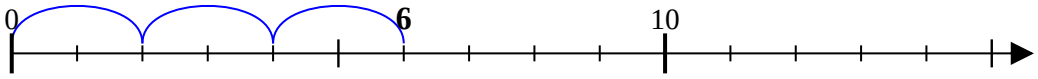

8) 12÷6=

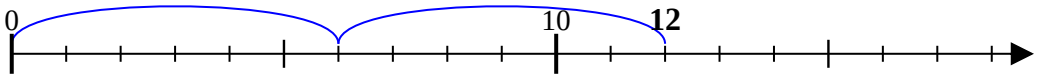

9) 6÷3=

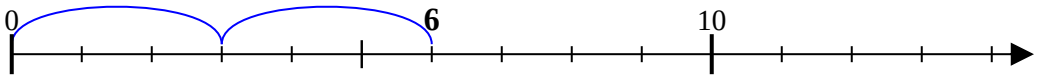

10) 18÷9=

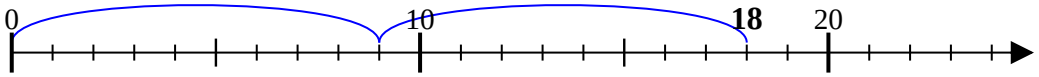

11) 45÷9=

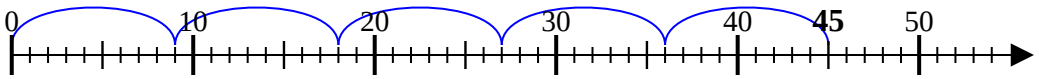

Respuestas

1. 3
2. 2
3. 4
4. 4
5. 2
6. 4
7. 3
8. 2
9. 2
10. 2
11. 5

1-10	91	82	73	64	55	45	36	27	18	9
11	0									

Dividiendo con una recta numérica Nombre:

Usa las rectas numéricas para resolver los problemas.

1) 30÷10=

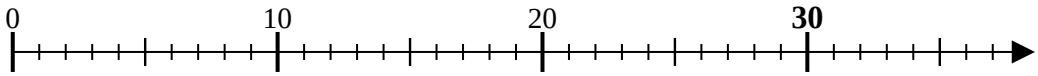

2) 28÷7=

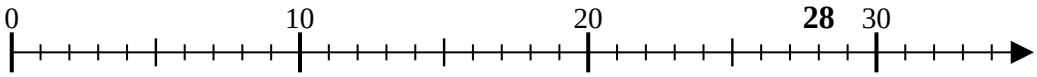

3) 6÷3=

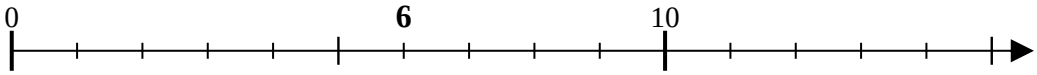

4) 32÷8=

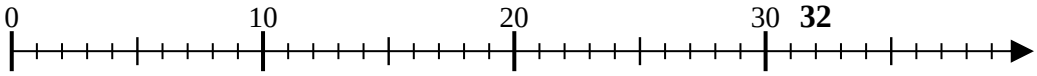

5) 15÷3=

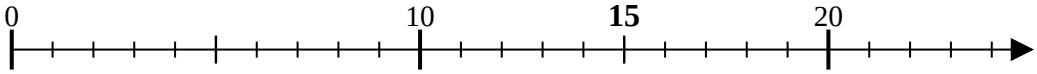

6) 10÷5=

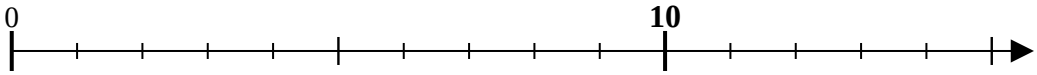

7) 18÷6=

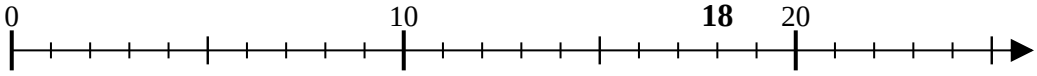

8) 20÷10=

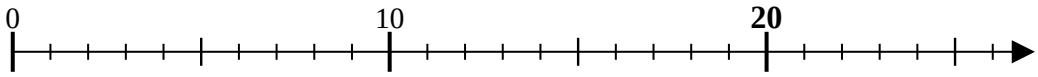

9) 36÷9=

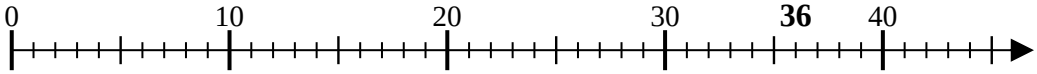

10) 20÷4=

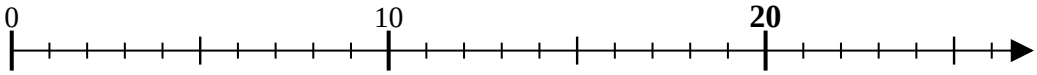

11) 9÷3=

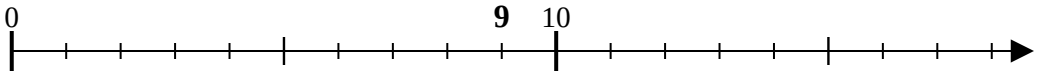

Respuestas

1. _____
2. _____
3. _____
4. _____
5. _____
6. _____
7. _____
8. _____
9. _____
10. _____
11. _____

1-10	91	82	73	64	55	45	36	27	18	9
11	0									

Usa las rectas numéricas para resolver los problemas.

1) 30÷10=

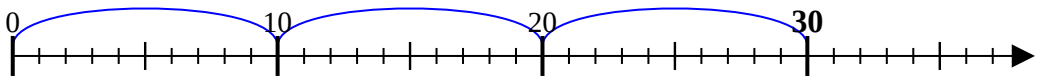

2) 28÷7=

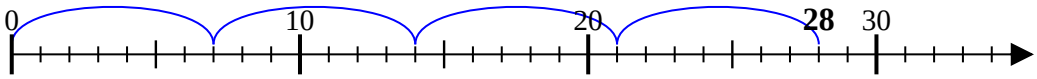

3) 6÷3=

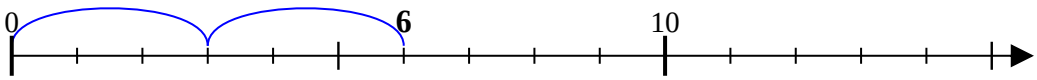

4) 32÷8=

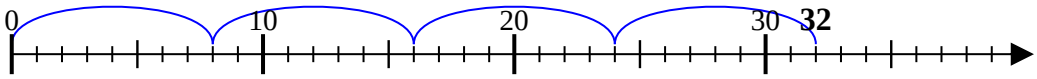

5) 15÷3=

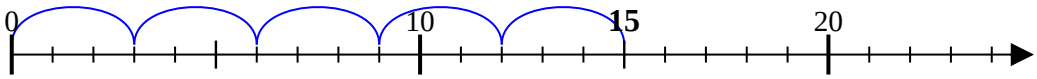

6) 10÷5=

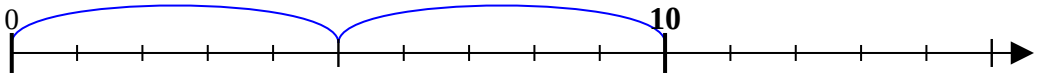

7) 18÷6=

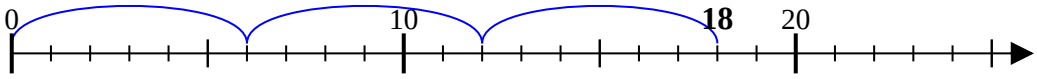

8) 20÷10=

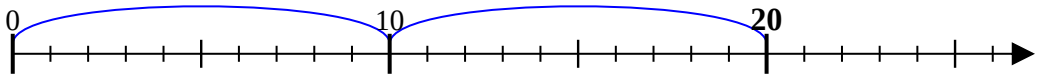

9) 36÷9=

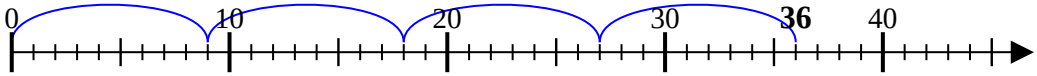

10) 20÷4=

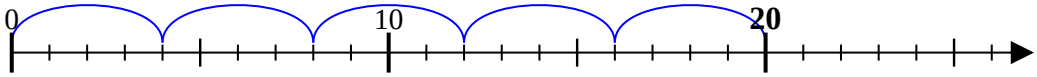

11) 9÷3=

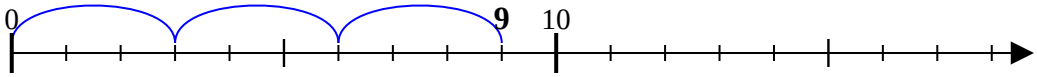

Respuestas

1. 3
2. 4
3. 2
4. 4
5. 5
6. 2
7. 3
8. 2
9. 4
10. 5
11. 3

1-10	91	82	73	64	55	45	36	27	18	9
11	0									

Dividiendo con una recta numérica Nombre:

Usa las rectas numéricas para resolver los problemas.

1) 9÷3=

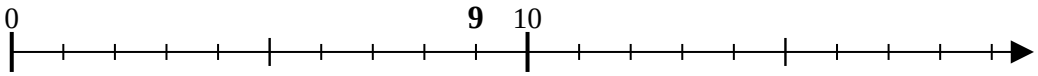

2) 10÷5=

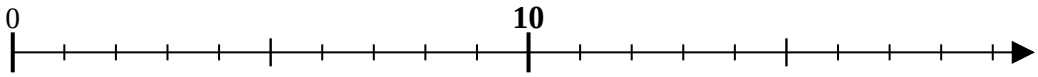

3) 32÷8=

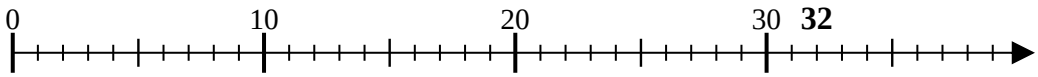

4) 8÷2=

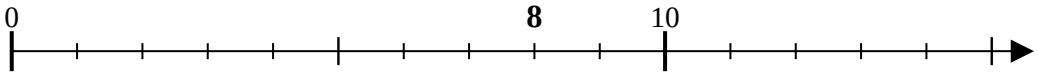

5) 24÷6=

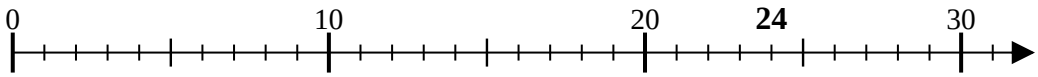

6) 8÷4=

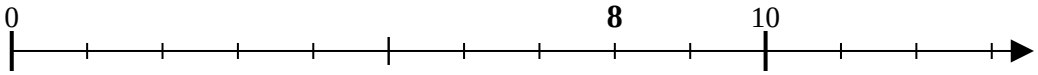

7) 4÷2=

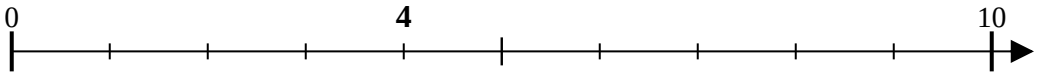

8) 30÷6=

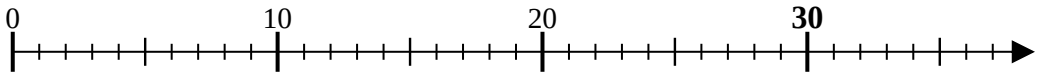

9) 20÷4=

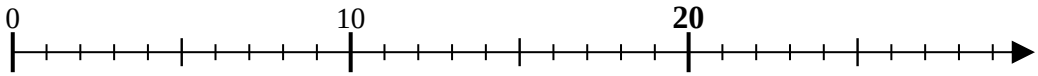

10) 12÷4=

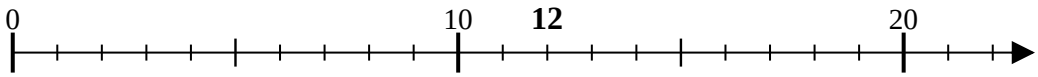

11) 50÷10=

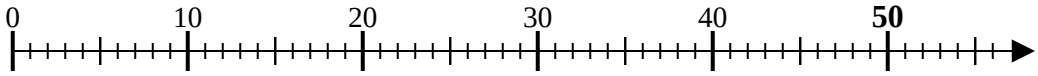

Respuestas

1. _____
2. _____
3. _____
4. _____
5. _____
6. _____
7. _____
8. _____
9. _____
10. _____
11. _____

1-10	91	82	73	64	55	45	36	27	18	9
11	0									

Usa las rectas numéricas para resolver los problemas.

1) 9÷3=

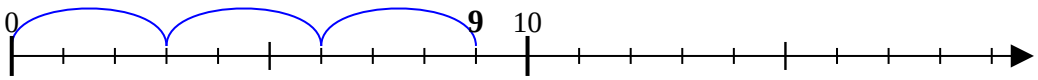

2) 10÷5=

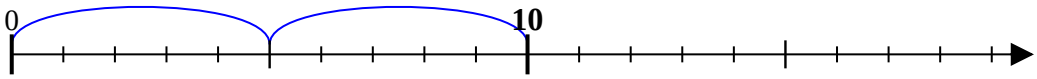

3) 32÷8=

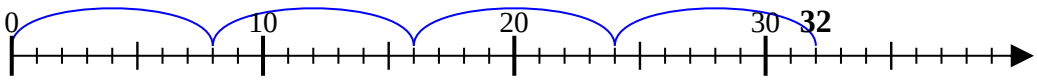

4) 8÷2=

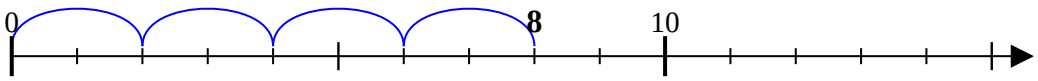

5) 24÷6=

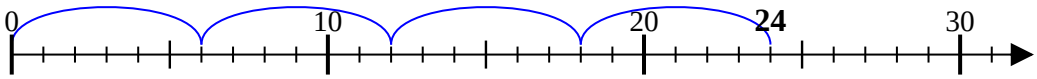

6) 8÷4=

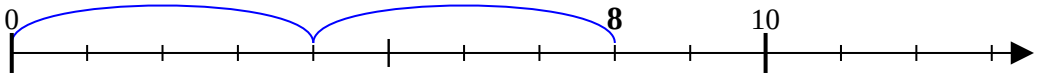

7) 4÷2=

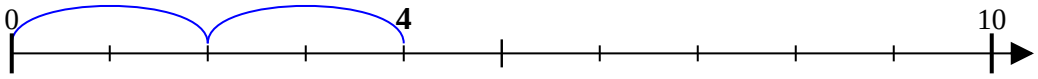

8) 30÷6=

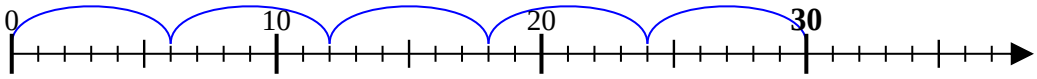

9) 20÷4=

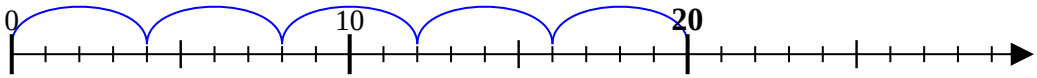

10) 12÷4=

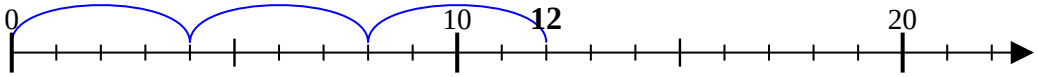

11) 50÷10=

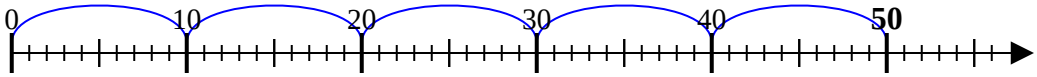

Respuestas

1. 3
2. 2
3. 4
4. 4
5. 4
6. 2
7. 2
8. 5
9. 5
10. 3
11. 5

1-10	91	82	73	64	55	45	36	27	18	9
11	0									

Dividiendo con una recta numérica Nombre:

Usa las rectas numéricas para resolver los problemas.

1) 35÷7=

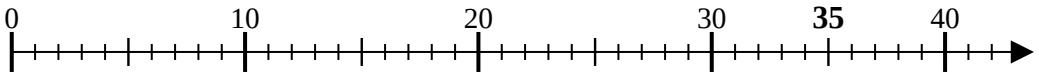

2) 21÷7=

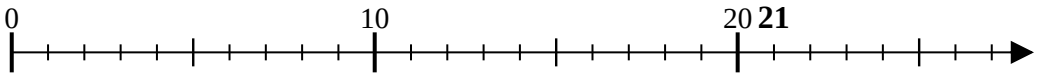

3) 12÷6=

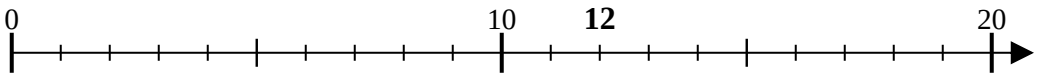

4) 6÷2=

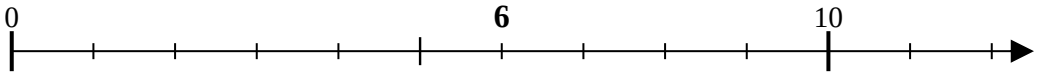

5) 28÷7=

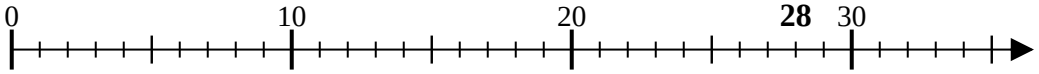

6) 10÷2=

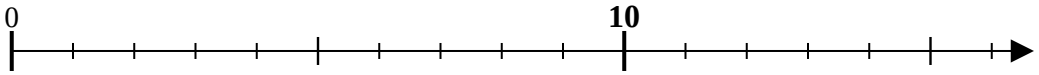

7) 9÷3=

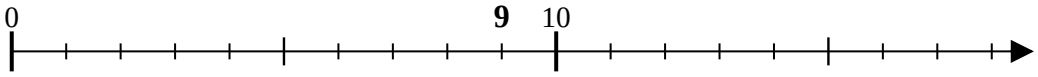

8) 18÷6=

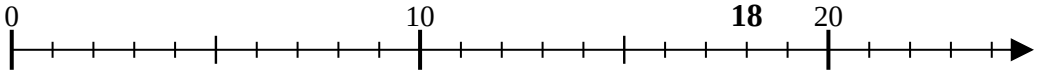

9) 10÷5=

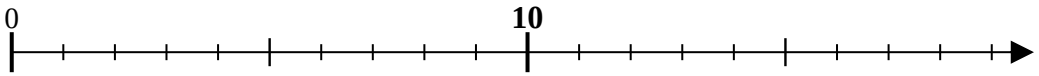

10) 18÷9=

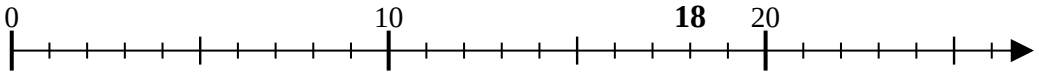

11) 24÷6=

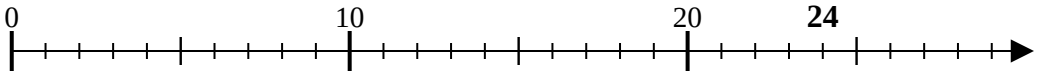

Respuestas

1. _____
2. _____
3. _____
4. _____
5. _____
6. _____
7. _____
8. _____
9. _____
10. _____
11. _____

1-10	91	82	73	64	55	45	36	27	18	9
11	0									

Usa las rectas numéricas para resolver los problemas.

1) 35÷7=

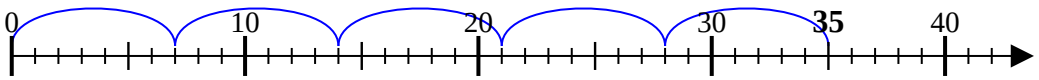

2) 21÷7=

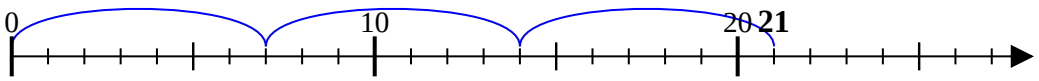

3) 12÷6=

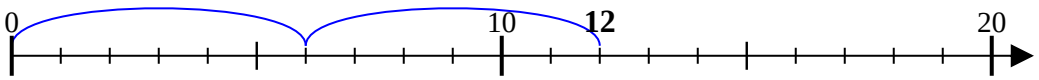

4) 6÷2=

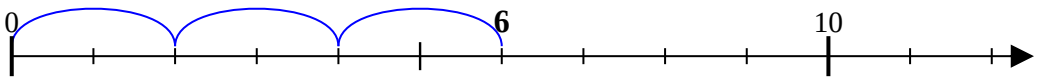

5) 28÷7=

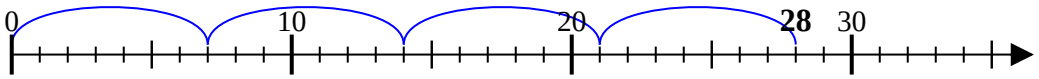

6) 10÷2=

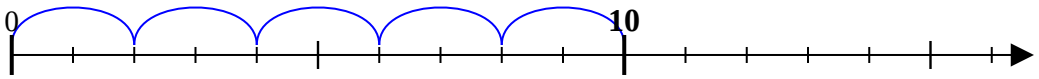

7) 9÷3=

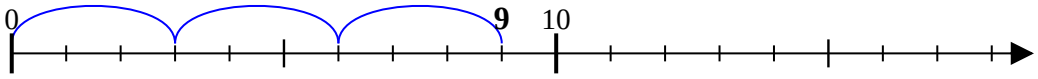

8) 18÷6=

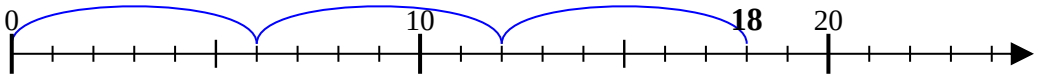

9) 10÷5=

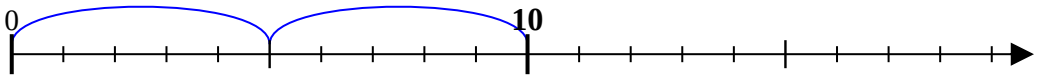

10) 18÷9=

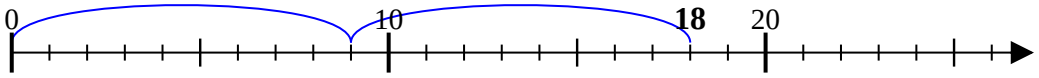

11) 24÷6=

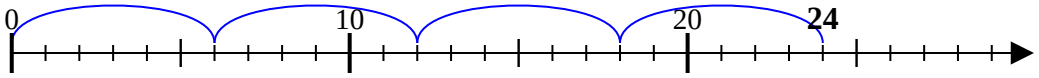

Respuestas

1. 5
2. 3
3. 2
4. 3
5. 4
6. 5
7. 3
8. 3
9. 2
10. 2
11. 4

1-10	91	82	73	64	55	45	36	27	18	9
11	0									

Dividiendo con una recta numérica Nombre:

Usa las rectas numéricas para resolver los problemas.

1) 12÷6=

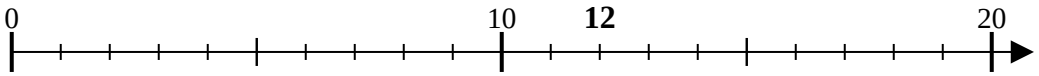

2) 50÷10=

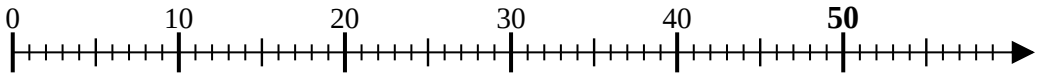

3) 6÷2=

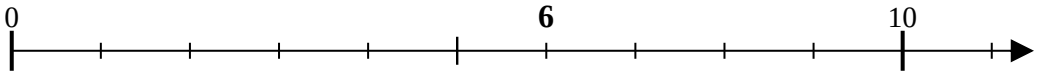

4) 10÷5=

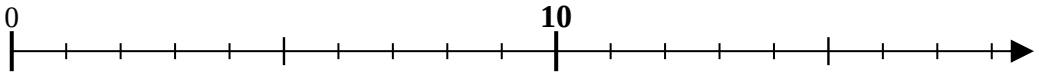

5) 16÷8=

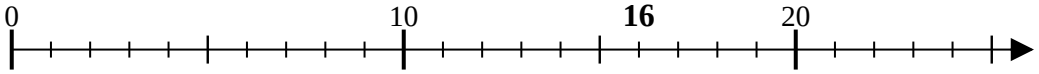

6) 8÷2=

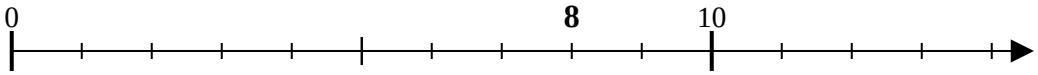

7) 35÷7=

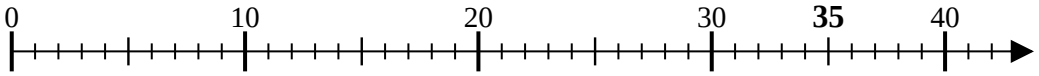

8) 40÷10=

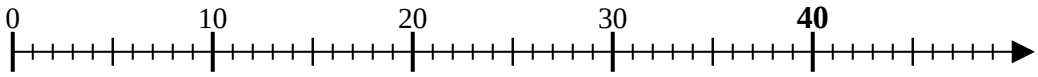

9) 18÷6=

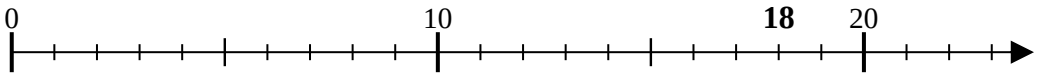

10) 25÷5=

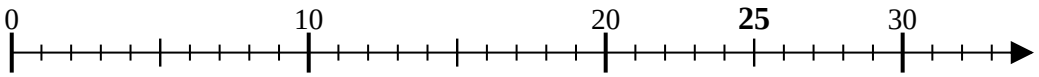

11) 30÷6=

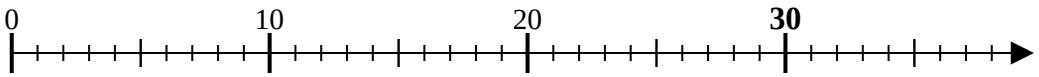

Respuestas

1. _____
2. _____
3. _____
4. _____
5. _____
6. _____
7. _____
8. _____
9. _____
10. _____
11. _____

1-10	91	82	73	64	55	45	36	27	18	9
11	0									

Usa las rectas numéricas para resolver los problemas.

1) 12÷6=

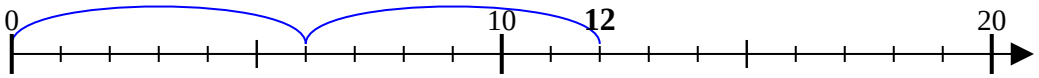

2) 50÷10=

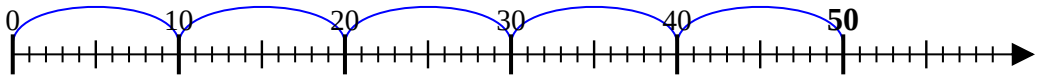

3) 6÷2=

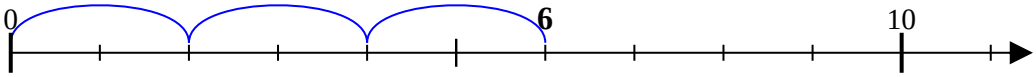

4) 10÷5=

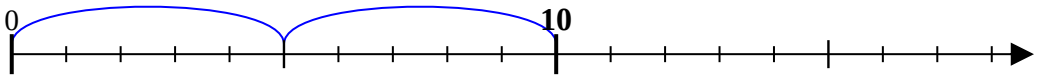

5) 16÷8=

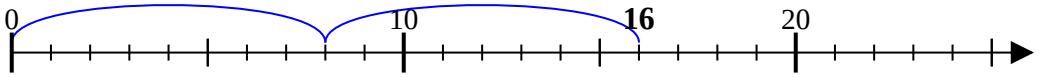

6) 8÷2=

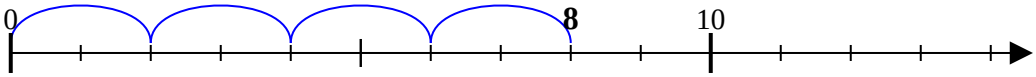

7) 35÷7=

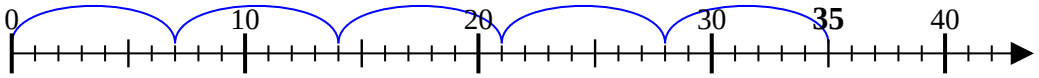

8) 40÷10=

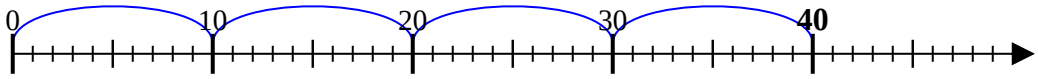

9) 18÷6=

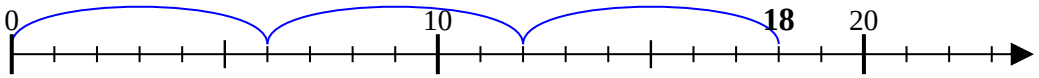

10) 25÷5=

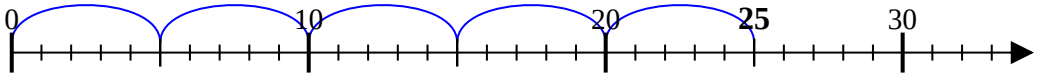

11) 30÷6=

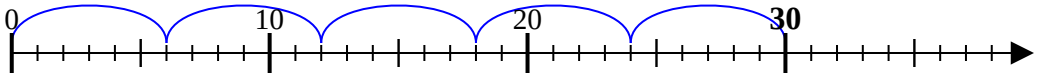

Respuestas

1. 2
2. 5
3. 3
4. 2
5. 2
6. 4
7. 5
8. 4
9. 3
10. 5
11. 5

1-10	91	82	73	64	55	45	36	27	18	9
11	0									

Dividiendo con una recta numérica Nombre:

Usa las rectas numéricas para resolver los problemas.

1) 24÷6=

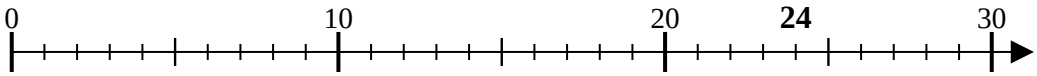

2) 16÷8=

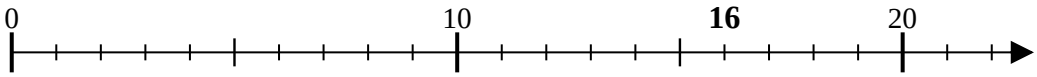

3) 10÷2=

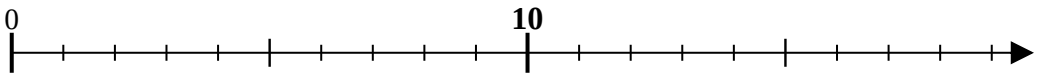

4) 40÷8=

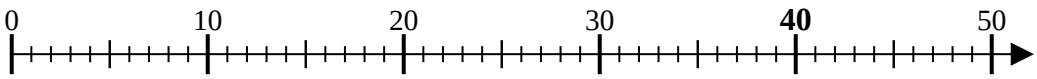

5) 6÷2=

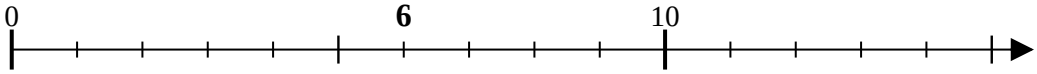

6) 40÷10=

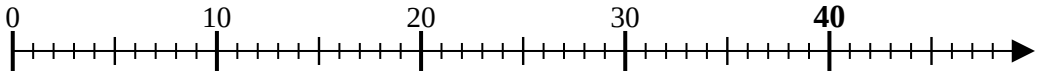

7) 15÷3=

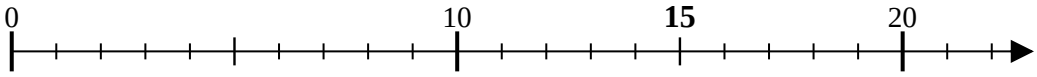

8) 18÷9=

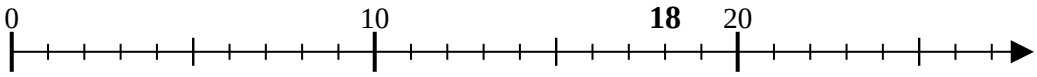

9) 27÷9=

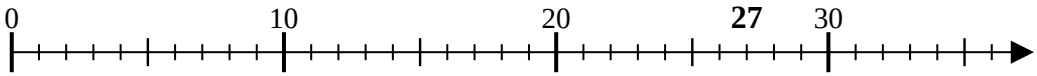

10) 36÷9=

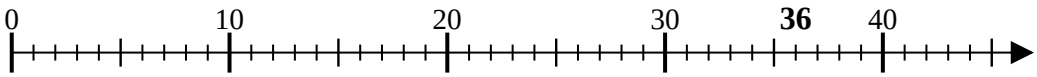

11) 8÷4=

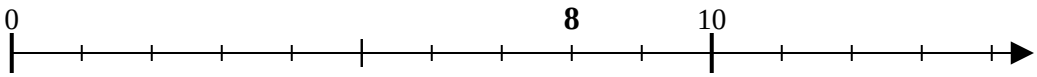

Respuestas

1. _____
2. _____
3. _____
4. _____
5. _____
6. _____
7. _____
8. _____
9. _____
10. _____
11. _____

1-10	91	82	73	64	55	45	36	27	18	9
11	0									

Usa las rectas numéricas para resolver los problemas.

1) 24÷6=

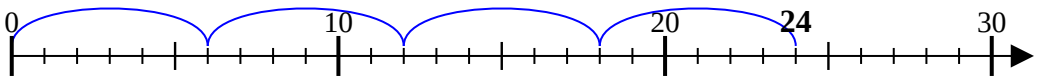

2) 16÷8=

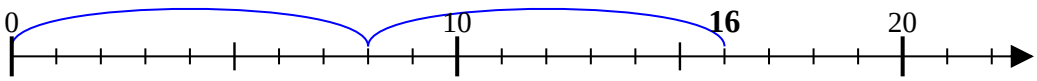

3) 10÷2=

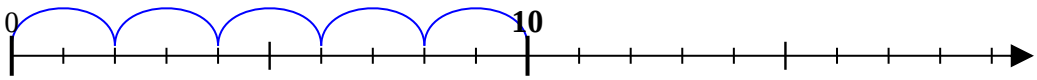

4) 40÷8=

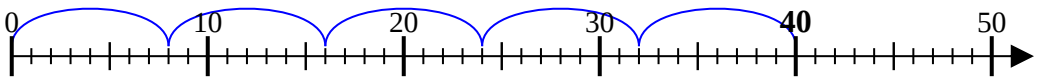

5) 6÷2=

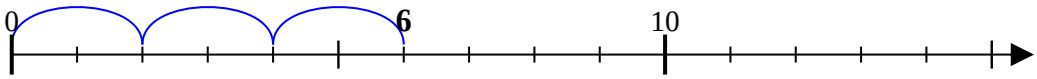

6) 40÷10=

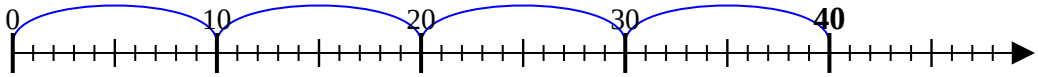

7) 15÷3=

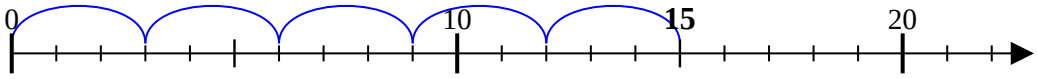

8) 18÷9=

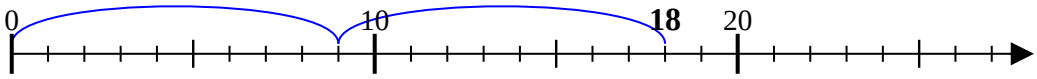

9) 27÷9=

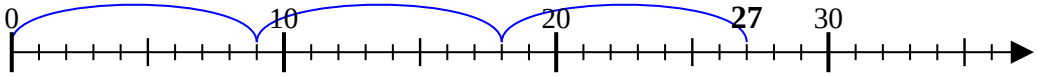

10) 36÷9=

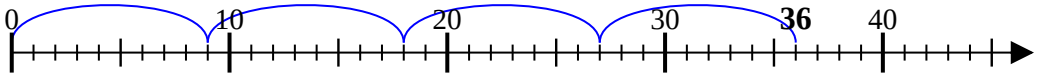

11) 8÷4=

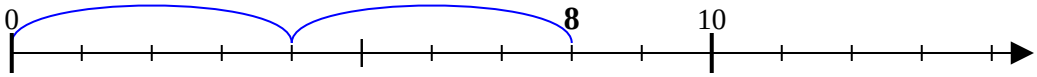

Respuestas

1. **4**
2. **2**
3. **5**
4. **5**
5. **3**
6. **4**
7. **5**
8. **2**
9. **3**
10. **4**
11. **2**

1-10	91	82	73	64	55	45	36	27	18	9
11	0									

Dividiendo con una recta numérica Nombre:

Usa las rectas numéricas para resolver los problemas.

1) 50÷10=

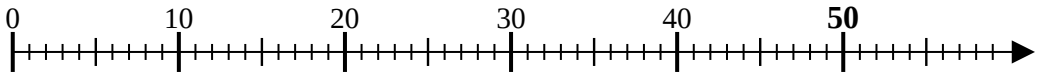

2) 16÷4=

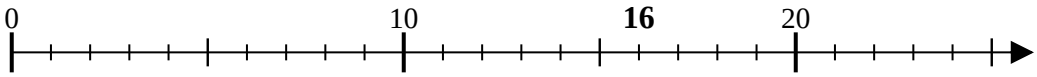

3) 14÷7=

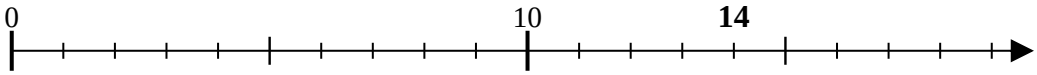

4) 28÷7=

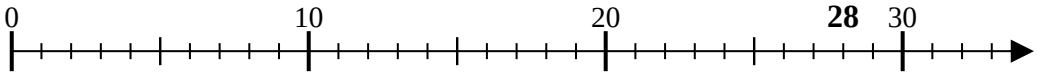

5) 20÷4=

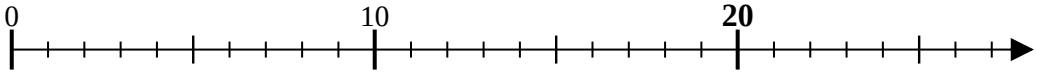

6) 45÷9=

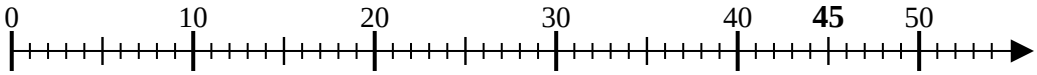

7) 20÷10=

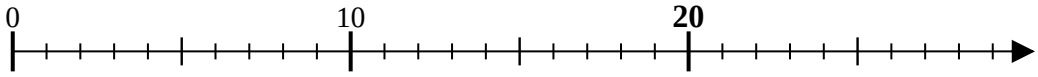

8) 16÷8=

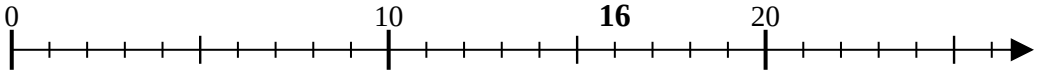

9) 12÷4=

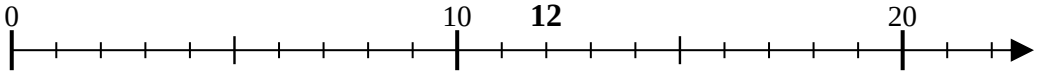

10) 4÷2=

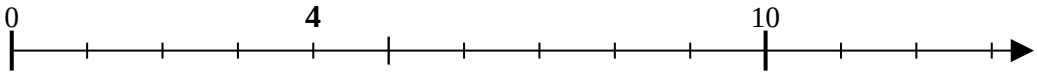

11) 36÷9=

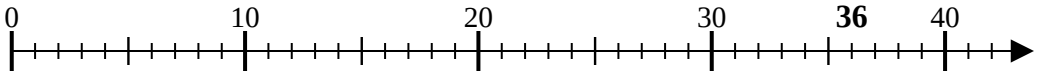

Respuestas

1. _____
2. _____
3. _____
4. _____
5. _____
6. _____
7. _____
8. _____
9. _____
10. _____
11. _____

1-10	91	82	73	64	55	45	36	27	18	9
11	0									

Usa las rectas numéricas para resolver los problemas.

1) 50÷10=

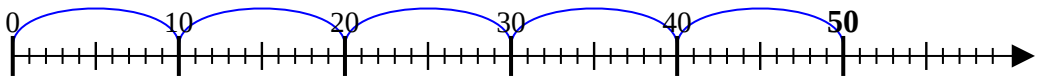

2) 16÷4=

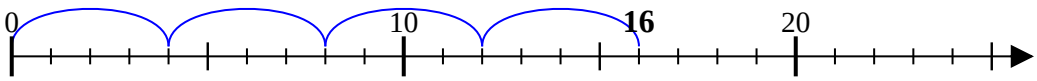

3) 14÷7=

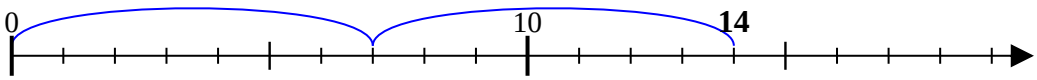

4) 28÷7=

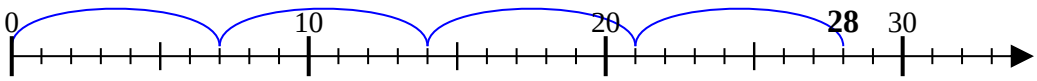

5) 20÷4=

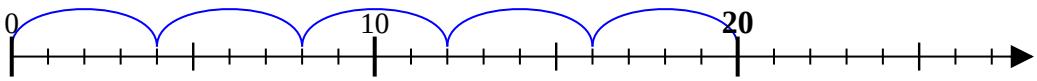

6) 45÷9=

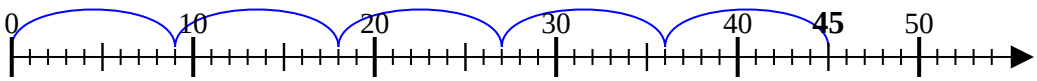

7) 20÷10=

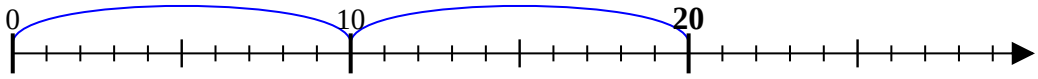

8) 16÷8=

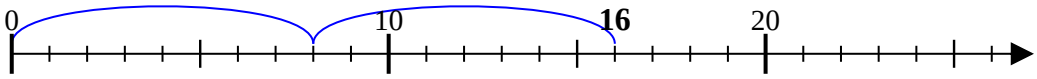

9) 12÷4=

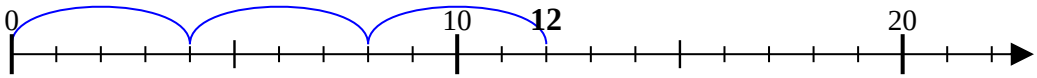

10) 4÷2=

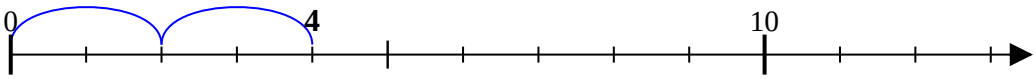

11) 36÷9=

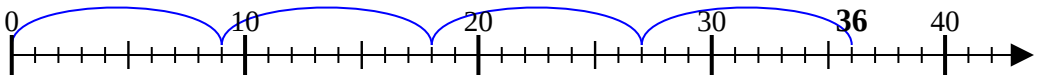

Respuestas

1. 5
2. 4
3. 2
4. 4
5. 5
6. 5
7. 2
8. 2
9. 3
10. 2
11. 4

1-10	91	82	73	64	55	45	36	27	18	9
11	0									

Dividiendo con una recta numérica Nombre:

Usa las rectas numéricas para resolver los problemas.

1) 6÷2=

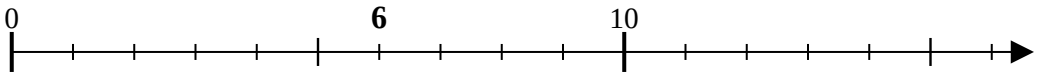

2) 18÷9=

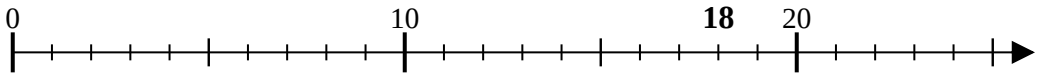

3) 28÷7=

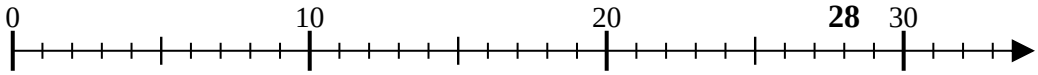

4) 45÷9=

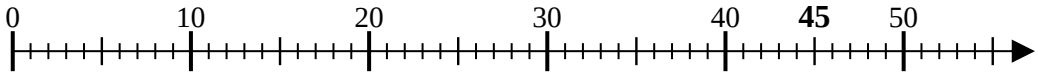

5) 8÷4=

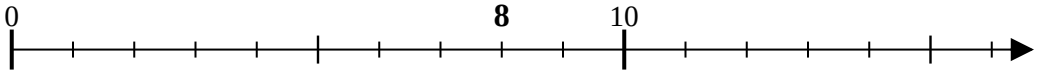

6) 30÷10=

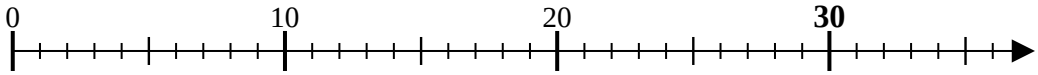

7) 14÷7=

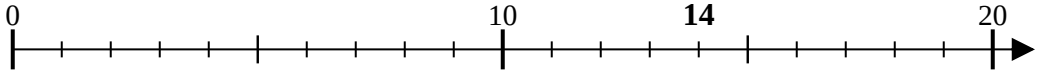

8) 16÷4=

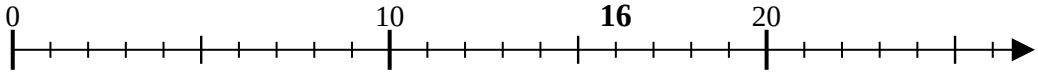

9) 15÷3=

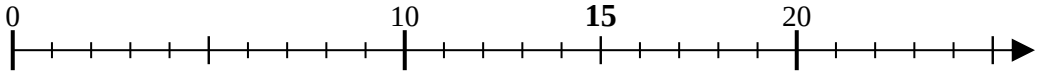

10) 12÷6=

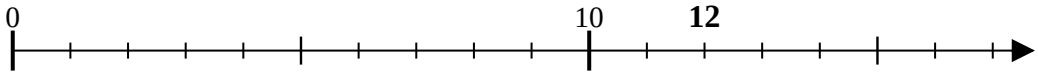

11) 25÷5=

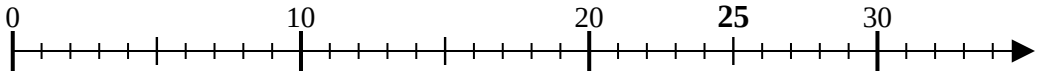

Respuestas

1. _____
2. _____
3. _____
4. _____
5. _____
6. _____
7. _____
8. _____
9. _____
10. _____
11. _____

1-10	91	82	73	64	55	45	36	27	18	9
11	0									

Usa las rectas numéricas para resolver los problemas.

1) 6÷2=

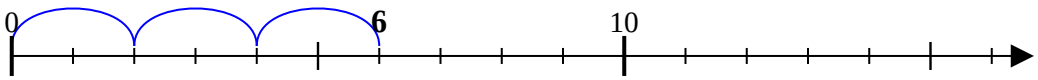

2) 18÷9=

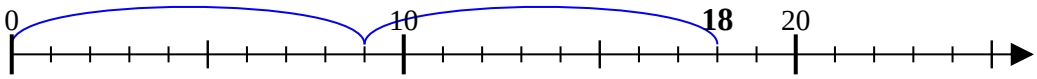

3) 28÷7=

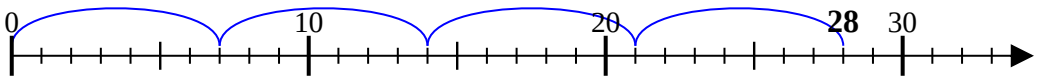

4) 45÷9=

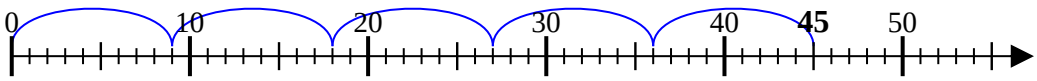

5) 8÷4=

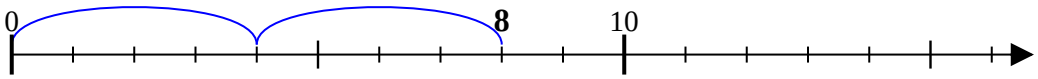

6) 30÷10=

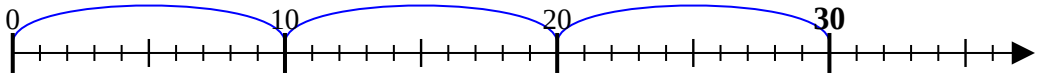

7) 14÷7=

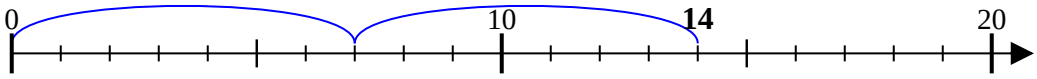

8) 16÷4=

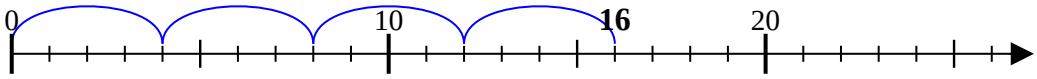

9) 15÷3=

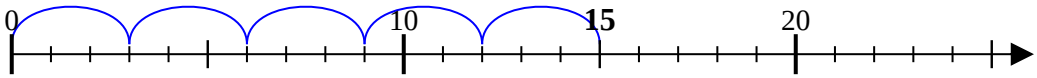

10) 12÷6=

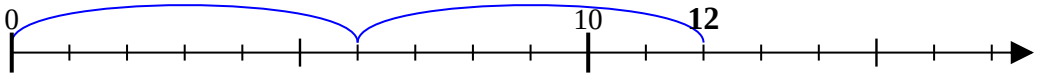

11) 25÷5=

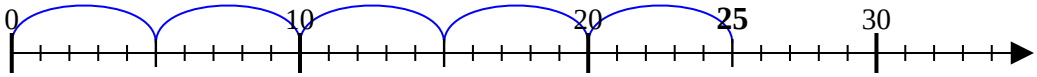

Respuestas

1. 3
2. 2
3. 4
4. 5
5. 2
6. 3
7. 2
8. 4
9. 5
10. 2
11. 5

1-10	91	82	73	64	55	45	36	27	18	9
11	0									

Dividiendo con una recta numérica Nombre:

Usa las rectas numéricas para resolver los problemas.

1) 18÷9=

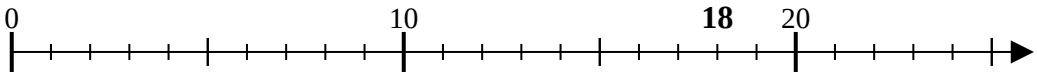

2) 15÷5=

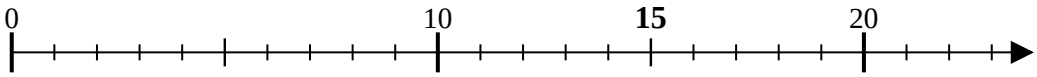

3) 8÷2=

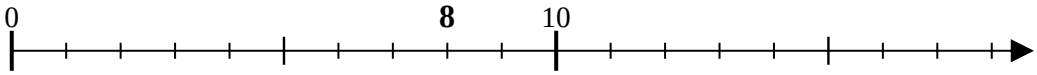

4) 16÷4=

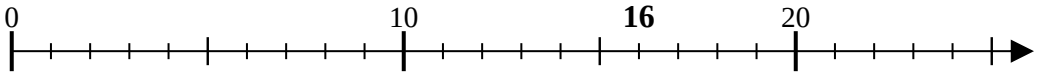

5) 40÷10=

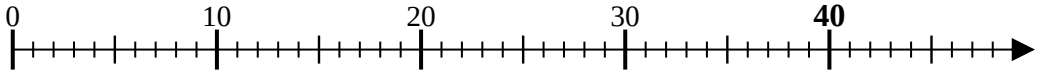

6) 4÷2=

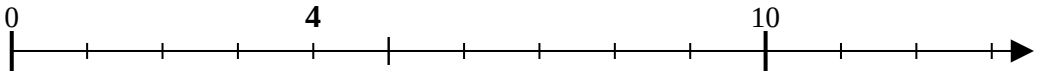

7) 45÷9=

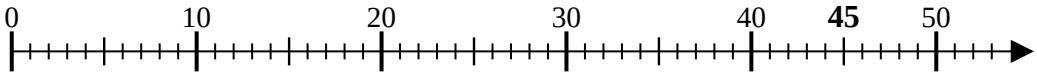

8) 15÷3=

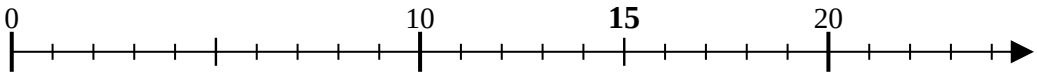

9) 28÷7=

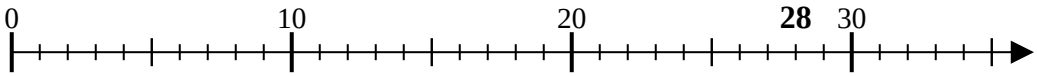

10) 16÷8=

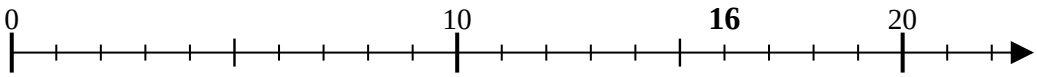

11) 8÷4=

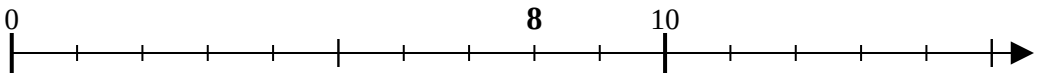

Respuestas

1. _____
2. _____
3. _____
4. _____
5. _____
6. _____
7. _____
8. _____
9. _____
10. _____
11. _____

1-10	91	82	73	64	55	45	36	27	18	9
11	0									

Usa las rectas numéricas para resolver los problemas.

1) 18÷9=

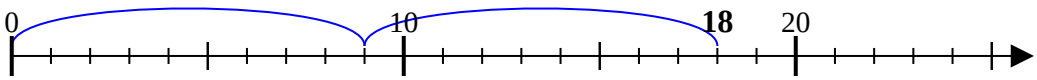

2) 15÷5=

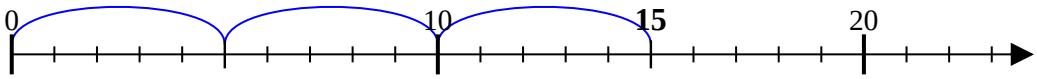

3) 8÷2=

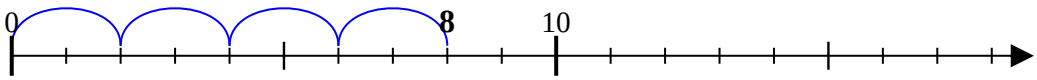

4) 16÷4=

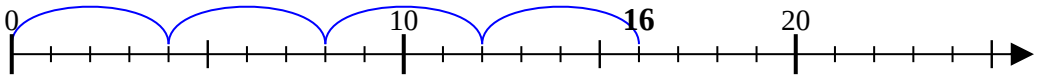

5) 40÷10=

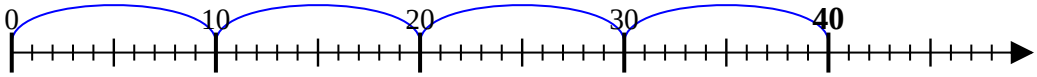

6) 4÷2=

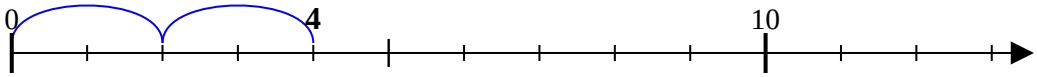

7) 45÷9=

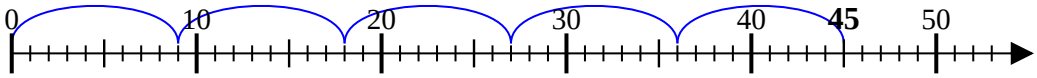

8) 15÷3=

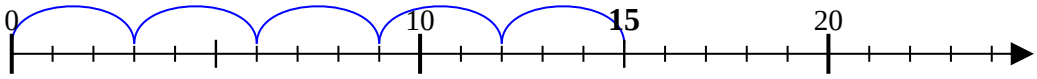

9) 28÷7=

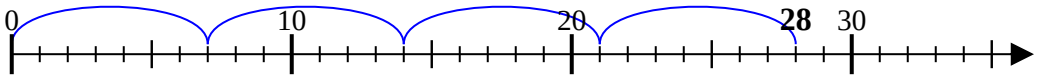

10) 16÷8=

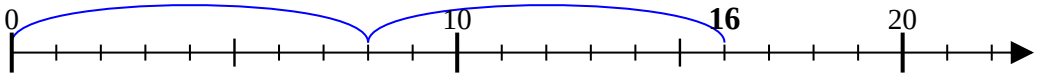

11) 8÷4=

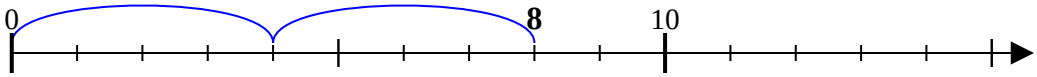

Respuestas

1. 2
2. 3
3. 4
4. 4
5. 4
6. 2
7. 5
8. 5
9. 4
10. 2
11. 2

1-10	91	82	73	64	55	45	36	27	18	9
11	0									