Determina el valor decimal (visual) Nombre:

Determina la cantidad sombreada del total. Escribe tu respuesta como un decimal.

1) 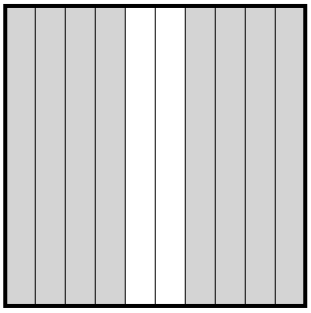

2) 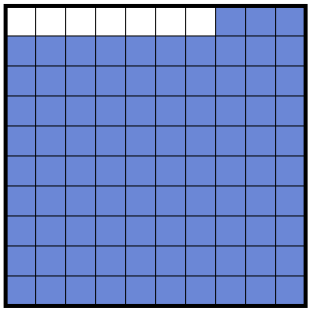

3) 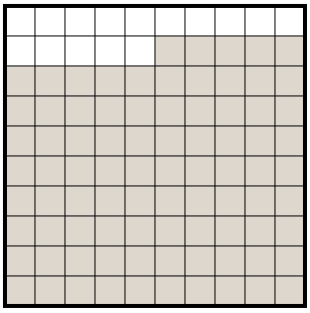

4) 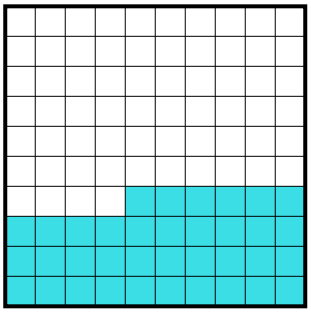

5) 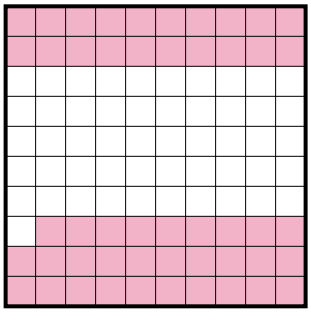

6) 

7) 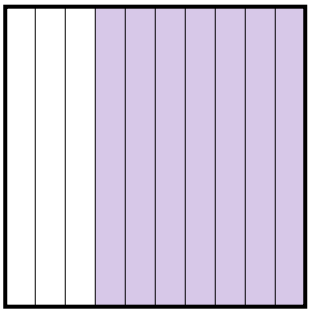

8) 

9) 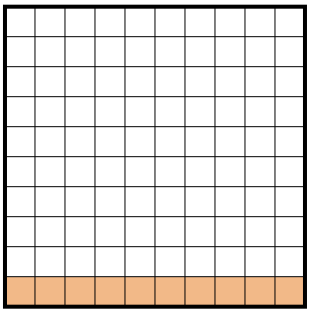

10) 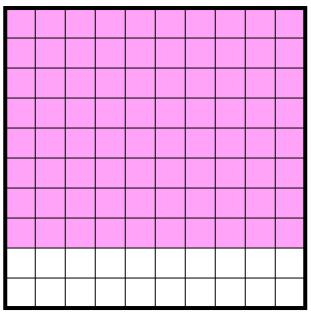

11) 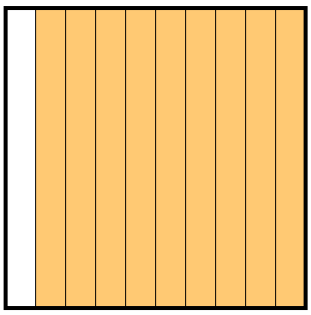

12) 

Respuestas

1. _____
2. _____
3. _____
4. _____
5. _____
6. _____
7. _____
8. _____
9. _____
10. _____
11. _____
12. _____

1-10	92	83	75	67	58	50	42	33	25	17
11-12	8	0								

Determina el valor decimal (visual) Nombre: **Clave De Respuestas**

Determina la cantidad sombreada del total. Escribe tu respuesta como un decimal.

1) 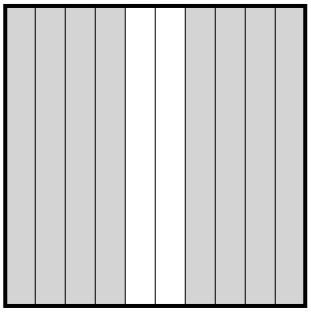

2) 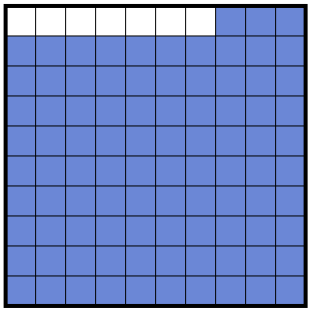

3) 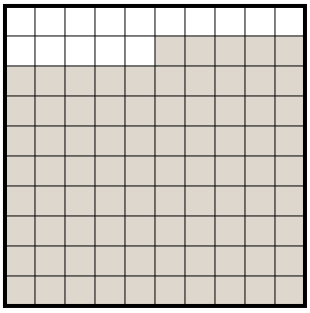

4) 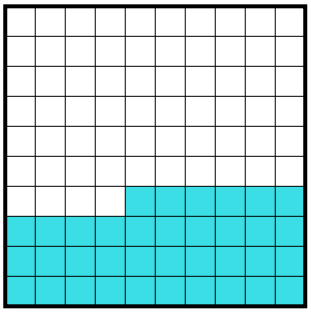

5) 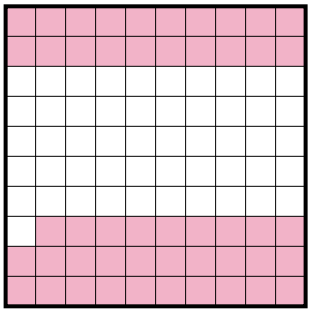

6) 

7) 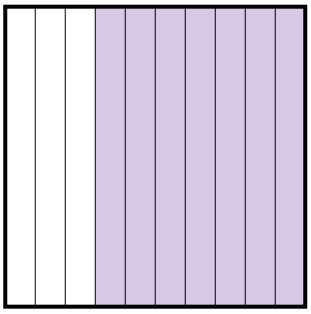

8) 

9) 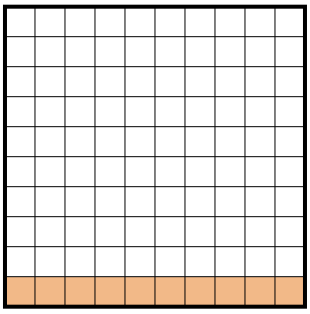

10) 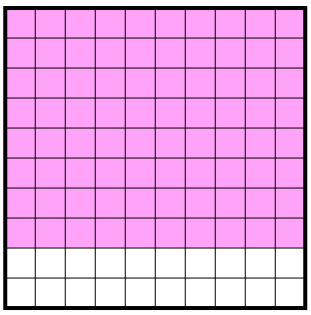

11) 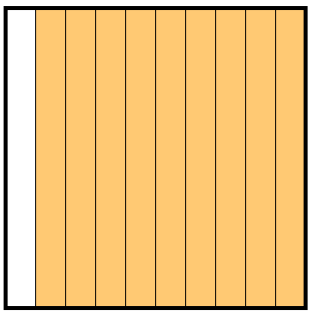

12) 

Respuestas

1. **0.8**
2. **0.93**
3. **0.85**
4. **0.36**
5. **0.49**
6. **0.2**
7. **0.7**
8. **0.61**
9. **0.1**
10. **0.8**
11. **0.9**
12. **0.6**

1-10	92	83	75	67	58	50	42	33	25	17
11-12	8	0								