Restar decimales con una recta numérica Nombre:

Usa la recta numérica para resolver cada problema.

1) 5.8 - 3.1 =



2) 7.4 - 2.3 =

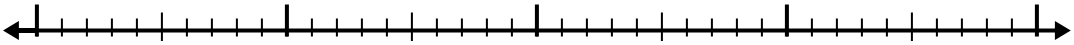

3) 10.3 - 3.1 =



4) 6.9 - 3.7 =

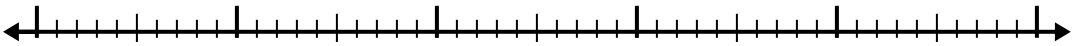

5) 11.2 - 3.6 =

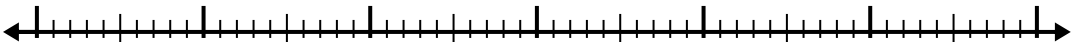

6) 4.5 - 2.7 =

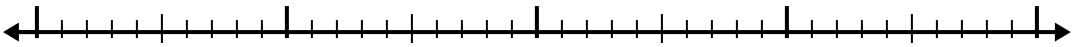

7) 4.1 - 2.4 =

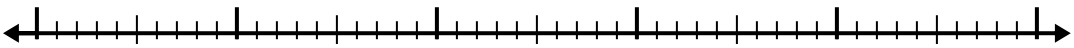

8) 12.4 - 3.6 =

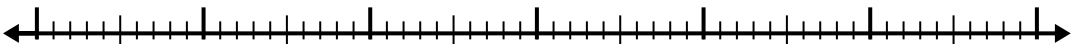

9) 11.5 - 2.6 =

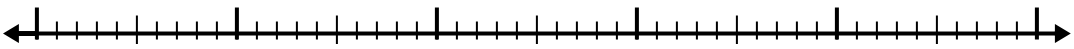

10) 9.2 - 3.9 =

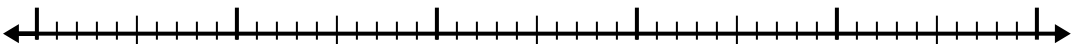

Respuestas

1. _____
2. _____
3. _____
4. _____
5. _____
6. _____
7. _____
8. _____
9. _____
10. _____

1-10	90	80	70	60	50	40	30	20	10	0

Restar decimales con una recta numérica

Nombre: **Clave De Respuestas**

Usa la recta numérica para resolver cada problema.

1) 5.8 - 3.1 =

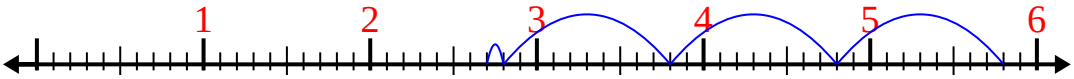

2) 7.4 - 2.3 =

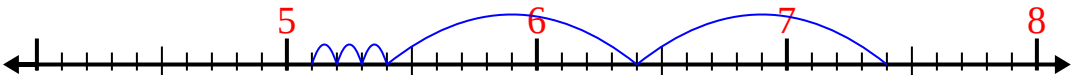

3) 10.3 - 3.1 =

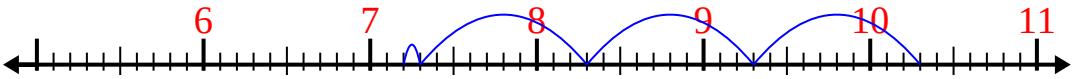

4) 6.9 - 3.7 =

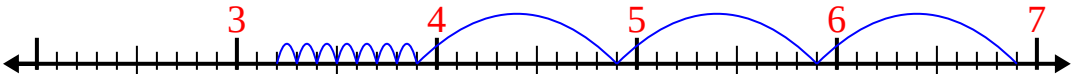

5) 11.2 - 3.6 =

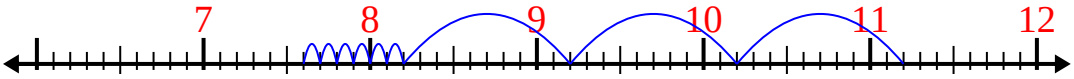

6) 4.5 - 2.7 =

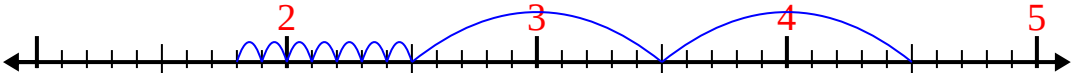

7) 4.1 - 2.4 =

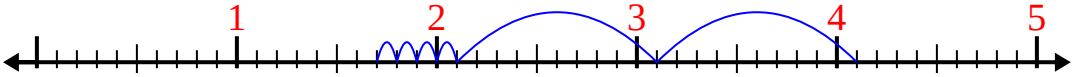

8) 12.4 - 3.6 =

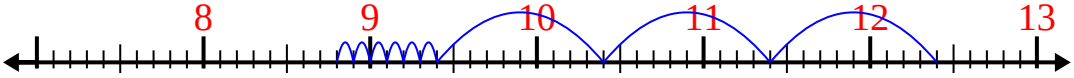

9) 11.5 - 2.6 =

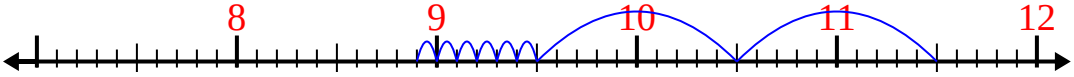

10) 9.2 - 3.9 =

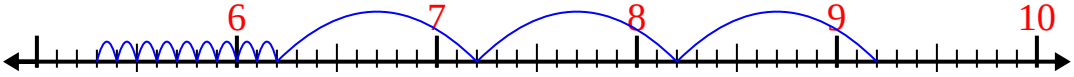

Respuestas

1. **2.7**
2. **5.1**
3. **7.2**
4. **3.2**
5. **7.6**
6. **1.8**
7. **1.7**
8. **8.8**
9. **8.9**
10. **5.3**

1-10	90	80	70	60	50	40	30	20	10	0