# Ordenando Decimales (Visualmente)

Nombre:

**Pon las cajas en orden de la menor a la mayor basado en la cantidad sombreada.**

**Ej)** A B C D

menor 0.2 - B
0.6 - D
0.86 - C
mayor 0.91 - A

**1)** A B C D

menor _____
_____
_____
mayor _____

**2)** A B C D

menor _____
_____
_____
mayor _____

**3)** A B C D

menor _____
_____
_____
mayor _____

**4)** A B C D

menor _____
_____
_____
mayor _____

**5)** A B C D

menor _____
_____
_____
mayor _____

**6)** A B C D

menor _____
_____
_____
mayor _____

**7)** A B C D

menor _____
_____
_____
mayor _____

**8)** A B C D

menor _____
_____
_____
mayor _____

## Respuestas

Ej. **B,D,C,A**

1. _____
2. _____
3. _____
4. _____
5. _____
6. _____
7. _____
8. _____



| 1-8 | 88 | 75 | 63 | 50 | 38 | 25 | 13 | 0 |
|---|---|---|---|---|---|---|---|---|

Ordenando Decimales (Visualmente) Nombre: **Clave De Respuestas**

**Pon las cajas en orden de la menor a la mayor basado en la cantidad sombreada.**

**Ej)**

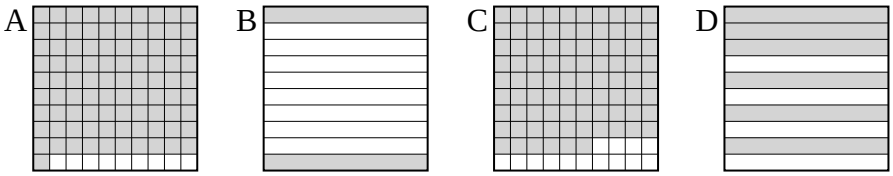


menor 0.2 - B
0.6 - D
0.86 - C
mayor 0.91 - A

**1)**

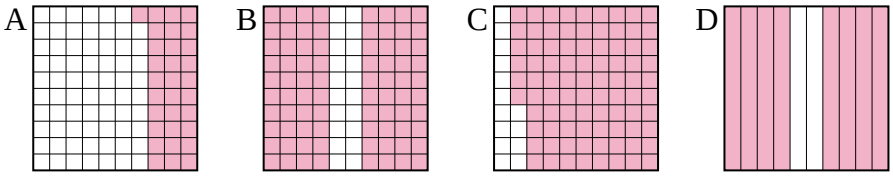


menor 0.31 - A
0.8 - B
0.8 - B
mayor 0.86 - C

**2)**

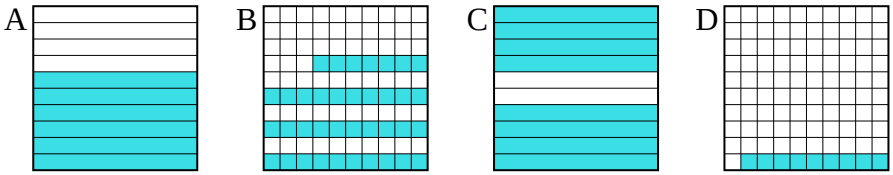


menor 0.09 - D
0.37 - B
0.6 - A
mayor 0.8 - C

**3)**

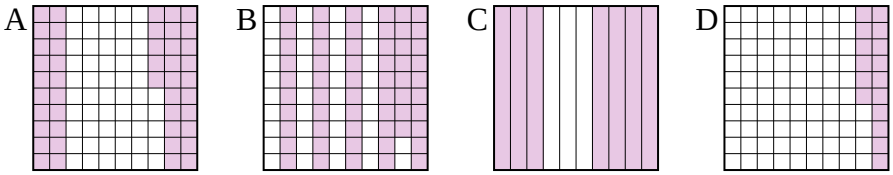


menor 0.16 - D
0.45 - A
0.58 - B
mayor 0.7 - C

**4)**

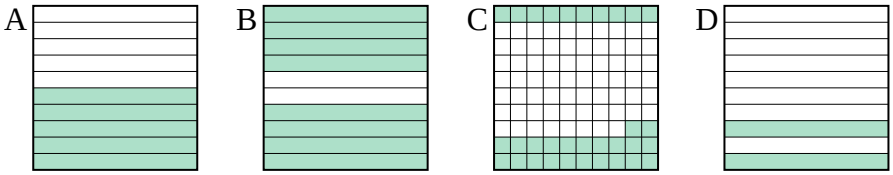


menor 0.2 - D
0.32 - C
0.5 - A
mayor 0.8 - B

**5)**

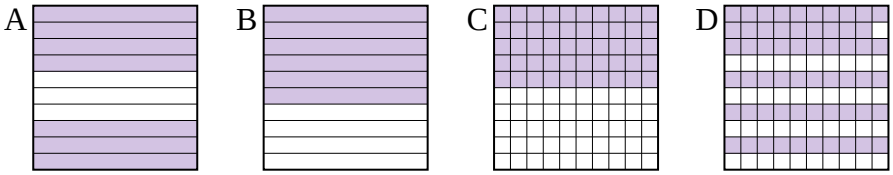


menor 0.5 - C
0.59 - D
0.6 - B
mayor 0.7 - A

**6)**

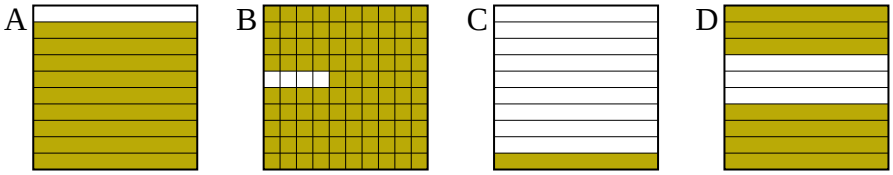


menor 0.1 - C
0.7 - D
0.9 - A
mayor 0.96 - B

**7)**

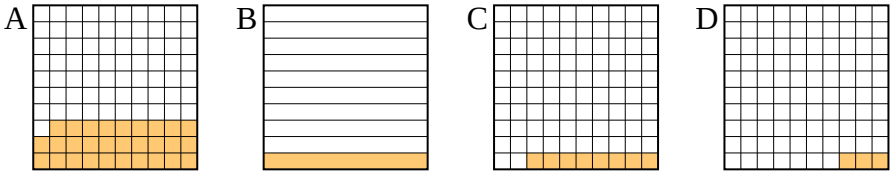


menor 0.03 - D
0.08 - C
0.1 - B
mayor 0.29 - A

**8)**

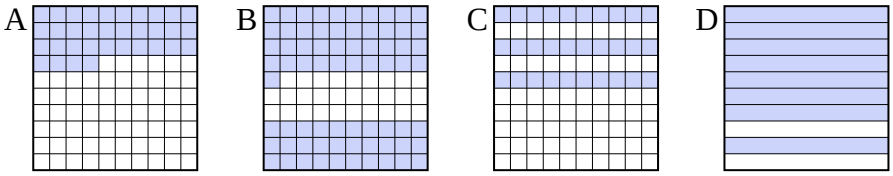


menor 0.3 - C
0.34 - A
0.71 - B
mayor 0.8 - D

## Respuestas

Ej. **B,D,C,A**

1. **A,B,B,C**
2. **D,B,A,C**
3. **D,A,B,C**
4. **D,C,A,B**
5. **C,D,B,A**
6. **C,D,A,B**
7. **D,C,B,A**
8. **C,A,B,D**



| 1-8 | 88 | 75 | 63 | 50 | 38 | 25 | 13 | 0 |
|---|---|---|---|---|---|---|---|---|