Determinación del valor decimal con bloques

Nombre:

Utilice el bloque de la izquierda para encontrar el valor del conjunto de bloques de la derecha.

1) 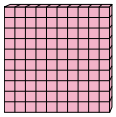 = 1 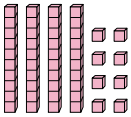

2)  = 1 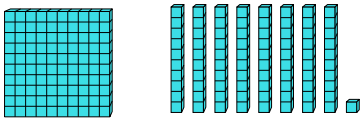

3) 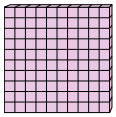 = 1 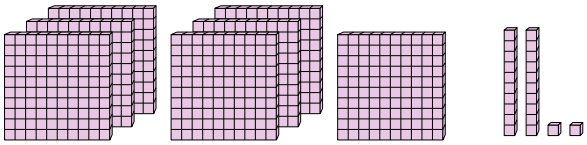

4)  = 1 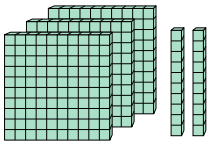

5) 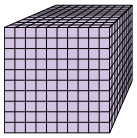 = 1 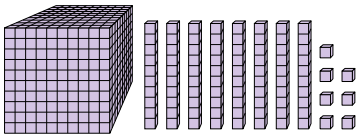

6) 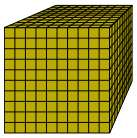 = 1 

7) 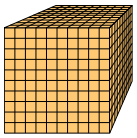 = 1 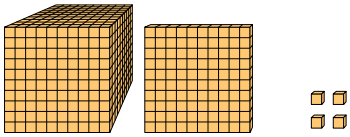

8) 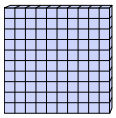 = 1 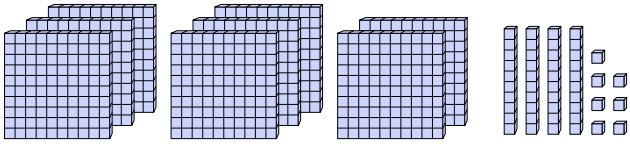

9) 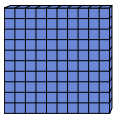 = 1 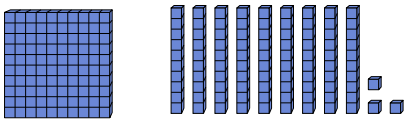

10) 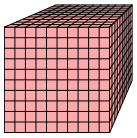 = 1 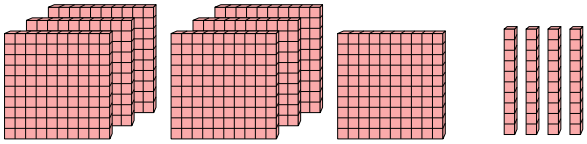

Respuestas

1. _____
2. _____
3. _____
4. _____
5. _____
6. _____
7. _____
8. _____
9. _____
10. _____

1-10	90	80	70	60	50	40	30	20	10	0

Determinación del valor decimal con bloques

Nombre: **Clave De Respuestas**

Utilice el bloque de la izquierda para encontrar el valor del conjunto de bloques de la derecha.

1) 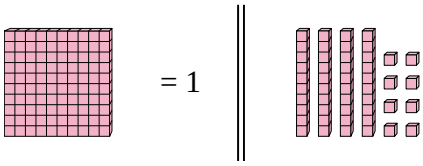

2) 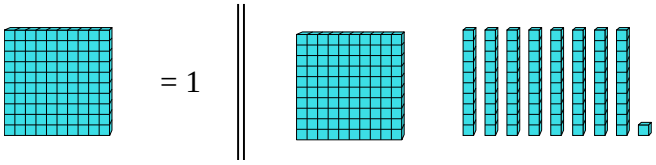

3) 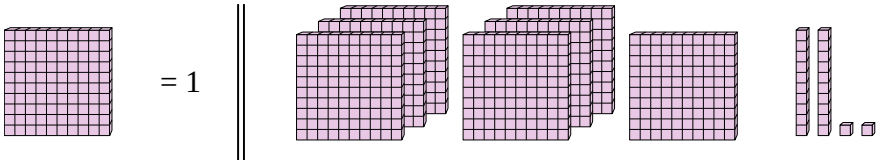

4) 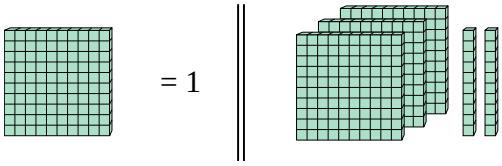

5) 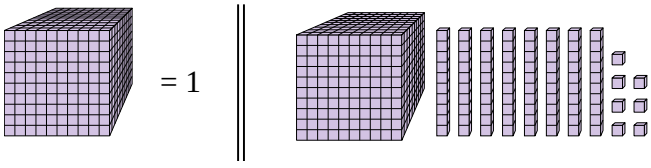

6) 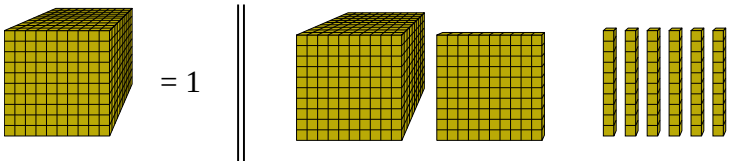

7) 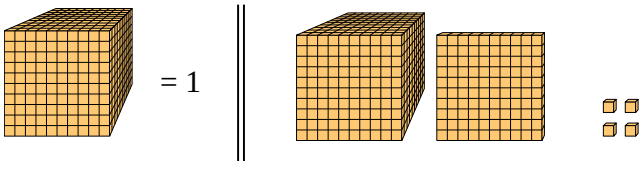

8) 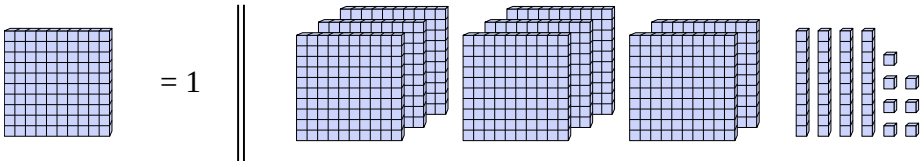

9) 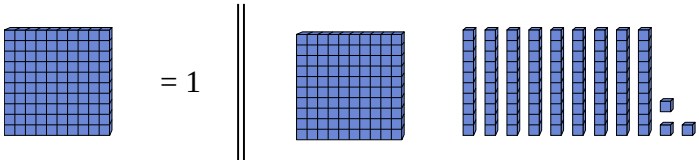

10) 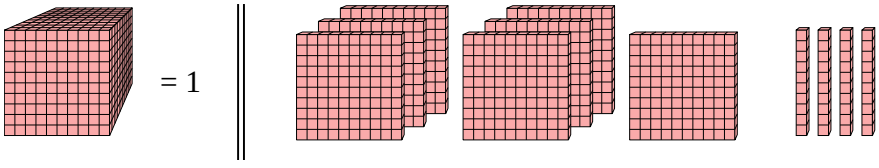

Respuestas

1. **0.48**
2. **1.81**
3. **7.22**
4. **3.2**
5. **1.087**
6. **1.16**
7. **1.104**
8. **8.47**
9. **1.93**
10. **0.74**

1-10	90	80	70	60	50	40	30	20	10	0