Contando Grupos de Diez

Nombre:

Determina la cantidad de grupos de diez. Luego encuentra el número total de bloques más pequeños.

1)

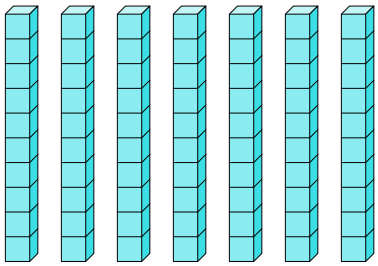

2)

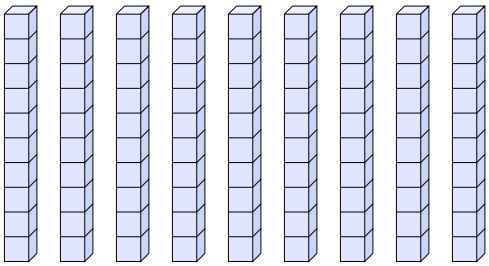

3)

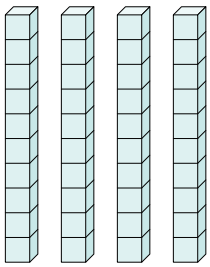

4)

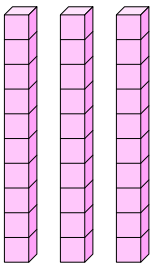

5)

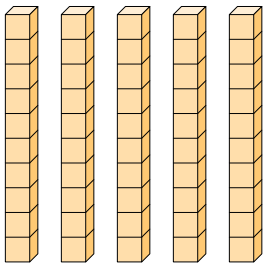

6)

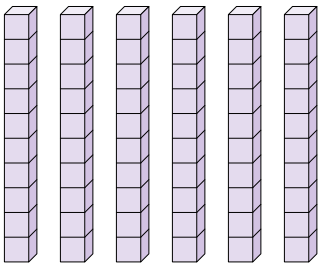

7)

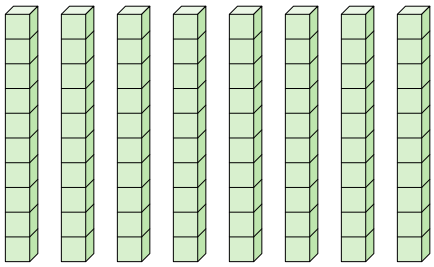

8)

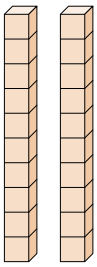

Respuestas

1. _____ _____
2. _____ _____
3. _____ _____
4. _____ _____
5. _____ _____
6. _____ _____
7. _____ _____
8. _____ _____

1-8	88	75	63	50	38	25	13	0

Contando Grupos de Diez

Nombre: **Clave De Respuestas**

Determina la cantidad de grupos de diez. Luego encuentra el número total de bloques más pequeños.

1)

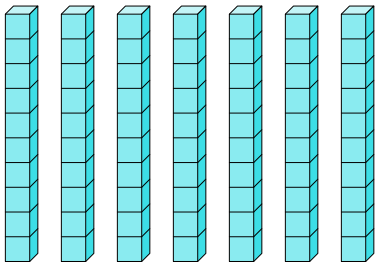

2)

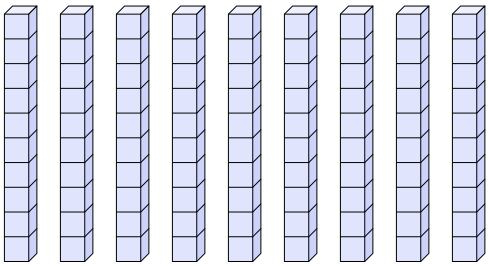

3)

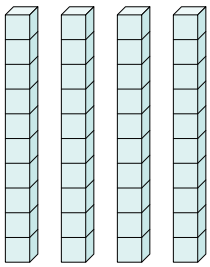

4)

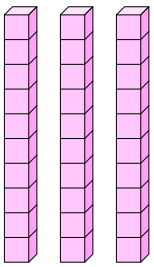

5)

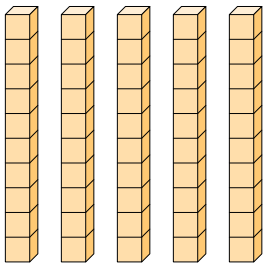

6)

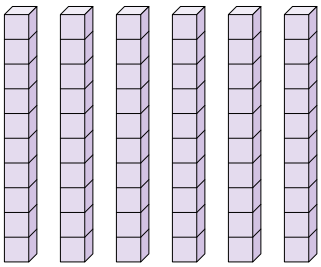

7)

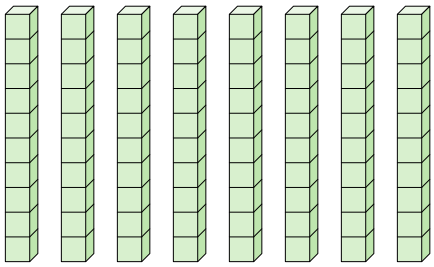

8)

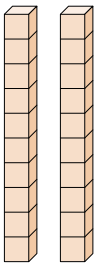

Respuestas

1.	7	70
2.	9	90
3.	4	40
4.	3	30
5.	5	50
6.	6	60
7.	8	80
8.	2	20

1-8	88	75	63	50	38	25	13	0