Crea un diagrama de cafa del conjunto de números.

1) 6 , 7 , 9 , 15 , 13 , 16 , 8 , 7 , 12 , 12

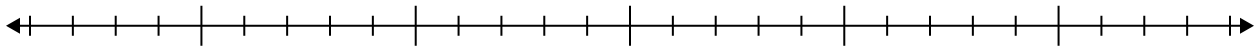

2) 29 , 53 , 40 , 82 , 99 , 74

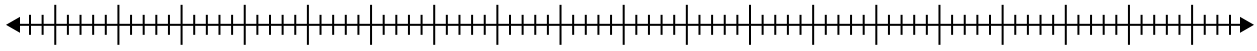

3) 19 , 8 , 12 , 20 , 20 , 5 , 6

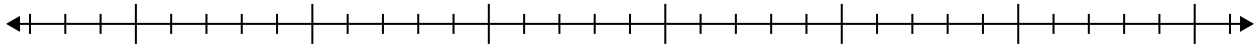

4) 35 , 20 , 74 , 98 , 23 , 51 , 61 , 90 , 76 , 93

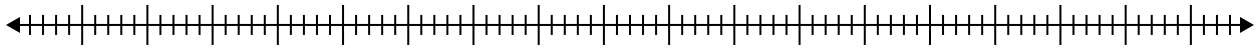

5) 5 , 11 , 18 , 20 , 15 , 12 , 18 , 8

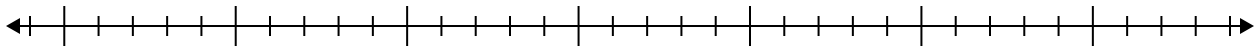

6) 83 , 40 , 64 , 48 , 31 , 74 , 73 , 32 , 58

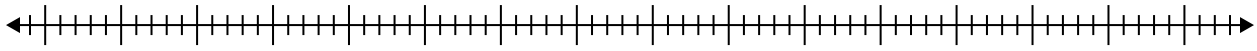

7) 96 , 57 , 94 , 87 , 30 , 55

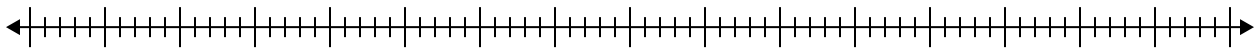

1-7	86	71	57	43	29	14	0

Crea un diagrama de cafa del conjunto de números.

1) 6 , 7 , 9 , 15 , 13 , 16 , 8 , 7 , 12 , 12 Min=6 Max=16 q1=7 Q2=10.5 q3=13

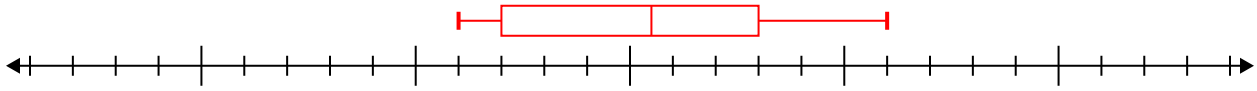

2) 29 , 53 , 40 , 82 , 99 , 74 Min=29 Max=99 q1=40 Q2=63.5 q3=82

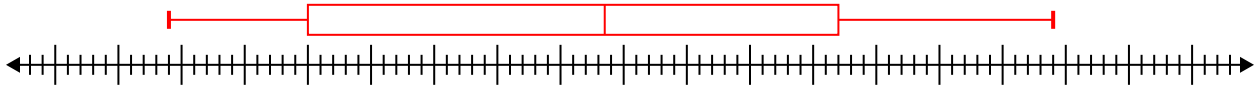

3) 19 , 8 , 12 , 20 , 20 , 5 , 6 Min=5 Max=20 q1=6 Q2=12 q3=20

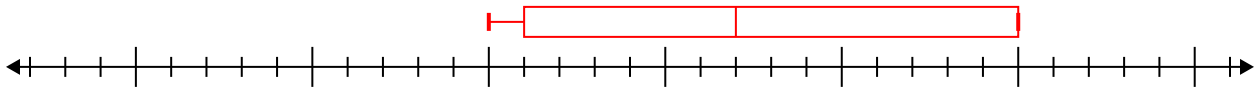

4) 35 , 20 , 74 , 98 , 23 , 51 , 61 , 90 , 76 , 93 Min=20 Max=98 q1=35 Q2=67.5 q3=90

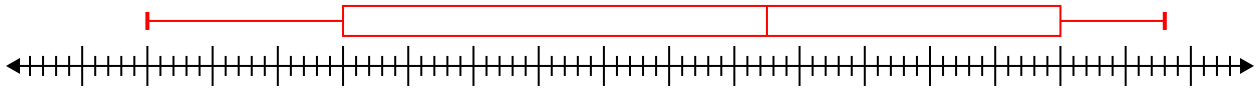

5) 5 , 11 , 18 , 20 , 15 , 12 , 18 , 8 Min=5 Max=20 q1=9.5 Q2=13.5 q3=18

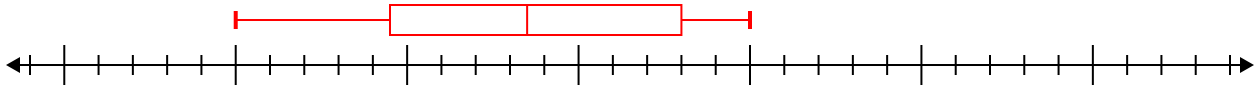

6) 83 , 40 , 64 , 48 , 31 , 74 , 73 , 32 , 58 Min=31 Max=83 q1=36 Q2=58 q3=73.5

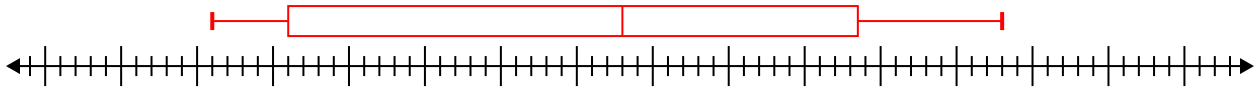

7) 96 , 57 , 94 , 87 , 30 , 55 Min=30 Max=96 q1=55 Q2=72 q3=94

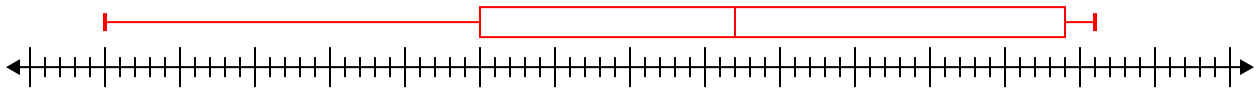

1-7	86	71	57	43	29	14	0