Encuentra el valor de X para cada figura. Cada figura está en centímetros (cm). No a escala.

1) area = 17.52 cm^2

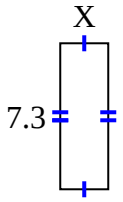

2) area = 38.88 cm^2

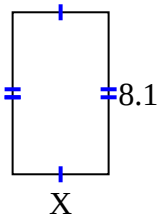

3) area = 50.76 cm^2

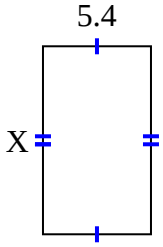

4) area = 24.5072 cm^2

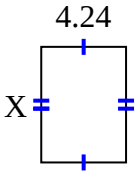

5) area = 92.061 cm^2

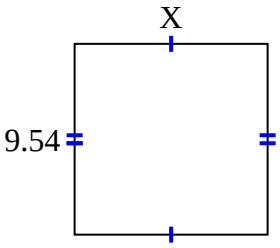

6) area = 14.6048 cm^2

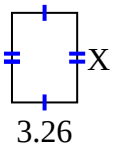

7) area = 41.038 cm^2

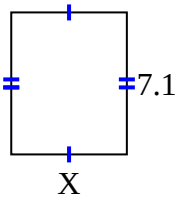

8) area = 46.8234 cm^2

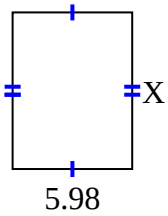

9) area = 24.2004 cm^2

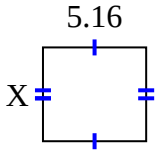

10) area = 29.64 cm^2

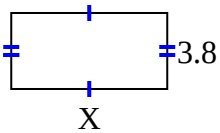

11) area = 30.178 cm^2

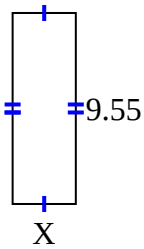

12) area = 55.896 cm^2

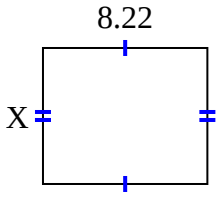

13) area = 20.075 cm^2

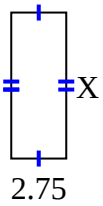

14) area = 19.55 cm^2

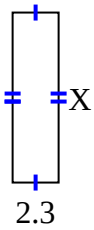

15) area = 30.15 cm^2

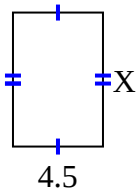

Respuestas

1. _____
2. _____
3. _____
4. _____
5. _____
6. _____
7. _____
8. _____
9. _____
10. _____
11. _____
12. _____
13. _____
14. _____
15. _____

1-10	93	87	80	73	67	60	53	47	40	33
11-15	27	20	13	7	0					

Encuentra el valor de X para cada figura. Cada figura está en centímetros (cm). No a escala.

1) area = 17.52 cm^2

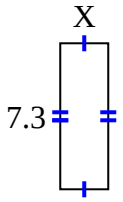

2) area = 38.88 cm^2

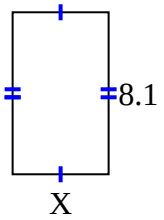

3) area = 50.76 cm^2

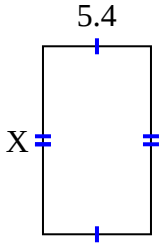

4) area = 24.5072 cm^2

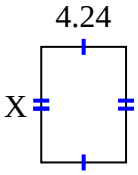

5) area = 92.061 cm^2

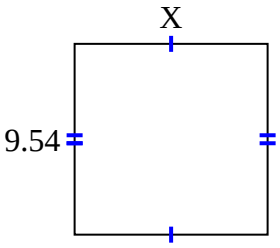

6) area = 14.6048 cm^2

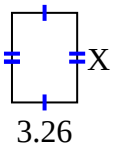

7) area = 41.038 cm^2

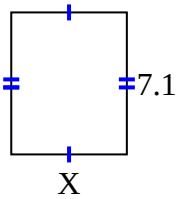

8) area = 46.8234 cm^2

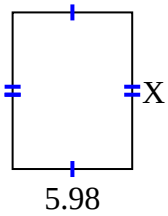

9) area = 24.2004 cm^2

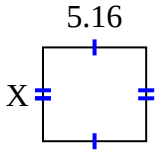

10) area = 29.64 cm^2

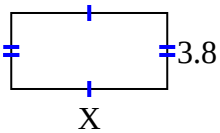

11) area = 30.178 cm^2

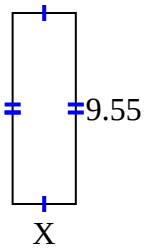

12) area = 55.896 cm^2

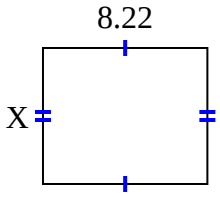

13) area = 20.075 cm^2

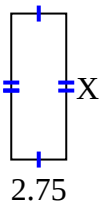

14) area = 19.55 cm^2

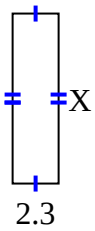

15) area = 30.15 cm^2

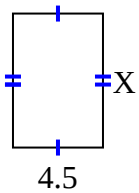

Respuestas

1. **2.4**
2. **4.8**
3. **9.4**
4. **5.78**
5. **9.65**
6. **4.48**
7. **5.78**
8. **7.83**
9. **4.69**
10. **7.8**
11. **3.16**
12. **6.8**
13. **7.3**
14. **8.5**
15. **6.7**

1-10	93	87	80	73	67	60	53	47	40	33
11-15	27	20	13	7	0					