Determinando áreas con bloques

Nombre:

Encuentra el área de cada sección sombreada. Cada bloque tiene 1 unidad cuadrada (u^2)

1)
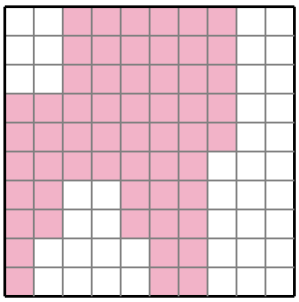

2)


3)
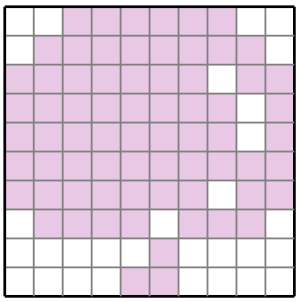

4)
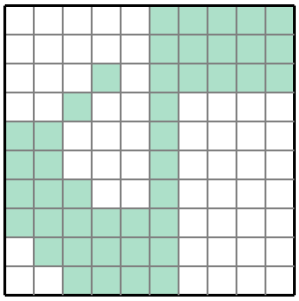

5)
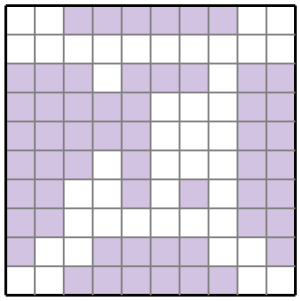

6)
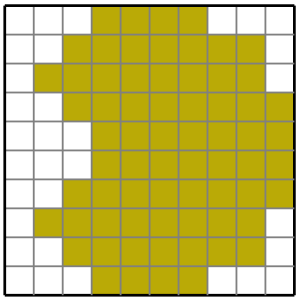

7)
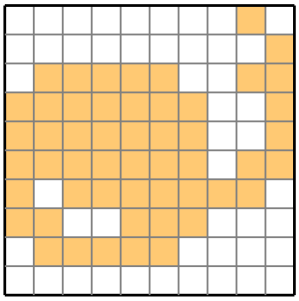

8)
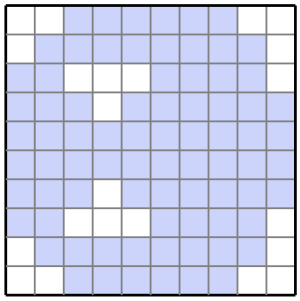

9)
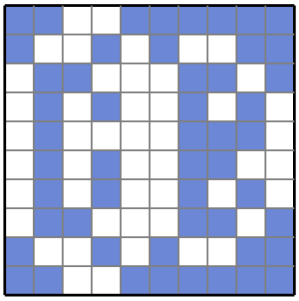

10)
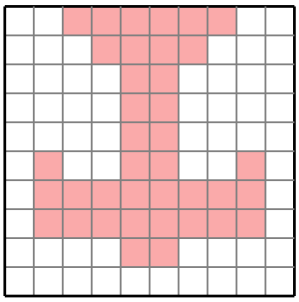

11)
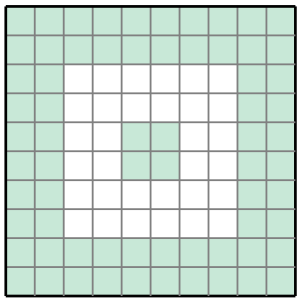

12)
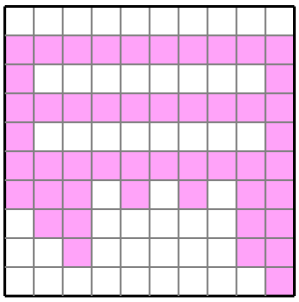

Respuestas

1. _____
2. _____
3. _____
4. _____
5. _____
6. _____
7. _____
8. _____
9. _____
10. _____
11. _____
12. _____

1-10	92	83	75	67	58	50	42	33	25	17
11-12	8	0								

Determinando áreas con bloques

Nombre: **Clave De Respuestas**

Encuentra el área de cada sección sombreada. Cada bloque tiene 1 unidad cuadrada (u^2)

1)

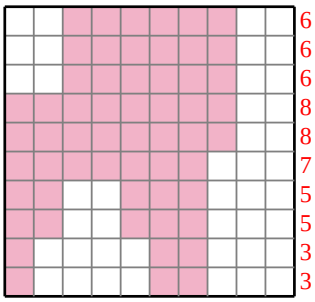

2)

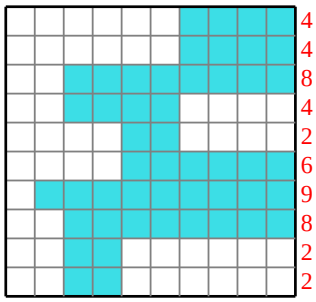

3)

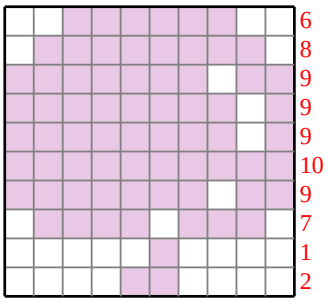

4)

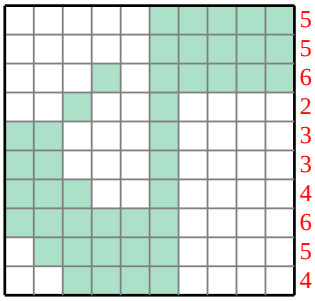

5)

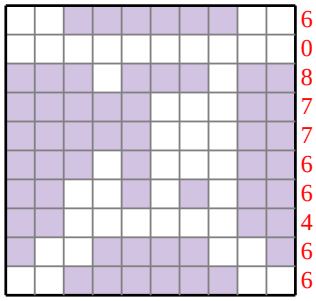

6)

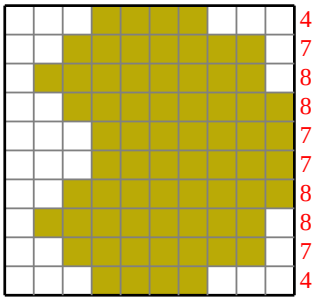

7)

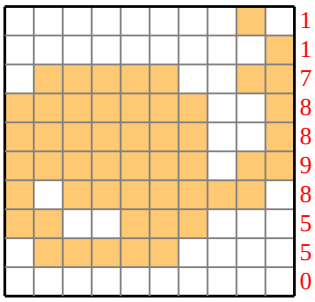

8)

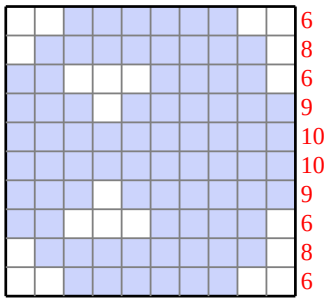

9)

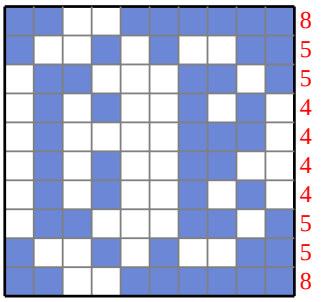

10)

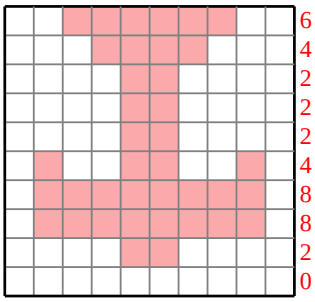

11)

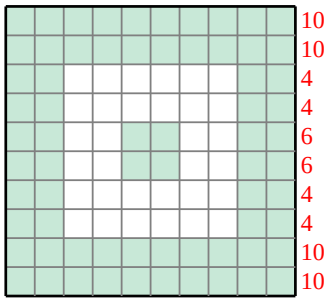

12)

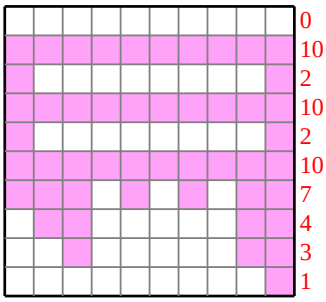

Respuestas

1. **57 u^2**
2. **49 u^2**
3. **70 u^2**
4. **43 u^2**
5. **56 u^2**
6. **68 u^2**
7. **52 u^2**
8. **78 u^2**
9. **52 u^2**
10. **38 u^2**
11. **68 u^2**
12. **49 u^2**

1-10	92	83	75	67	58	50	42	33	25	17
11-12	8	0								