Encontrando el área y circunferencia de un círculo. Nombre:

Encuentra el área y circunferencia de cada círculo. Los círculos no están a escala.

1)

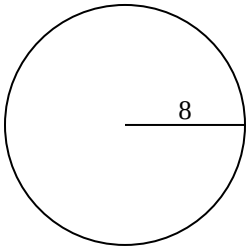

2)

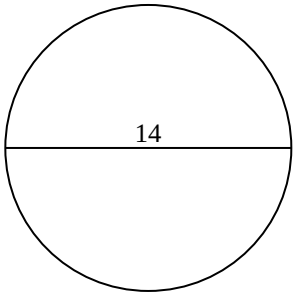

3)

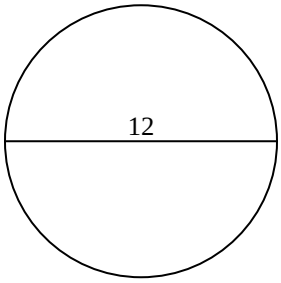

4)

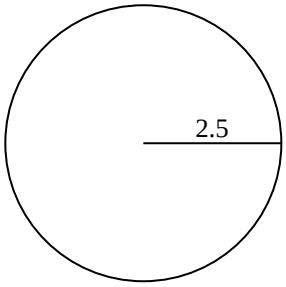

5)

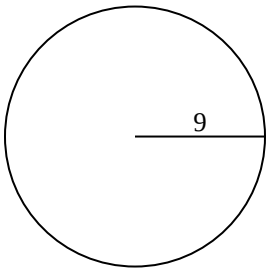

6)

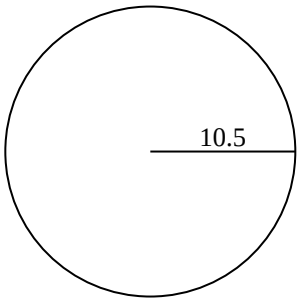

7)

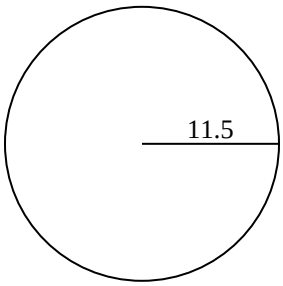

8)

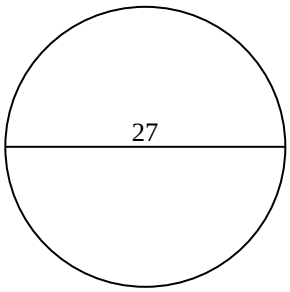

9)

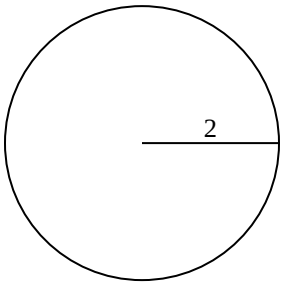

10)

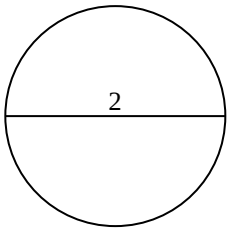

Respuestas

1. _____ _____
2. _____ _____
3. _____ _____
4. _____ _____
5. _____ _____
6. _____ _____
7. _____ _____
8. _____ _____
9. _____ _____
10. _____ _____

1-10	90	80	70	60	50	40	30	20	10	0

Encontrando el área y circunferencia de un círculo. Nombre: **Clave De Respuestas**

Encuentra el área y circunferencia de cada círculo. Los círculos no están a escala.

1)

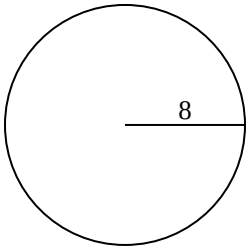

2)

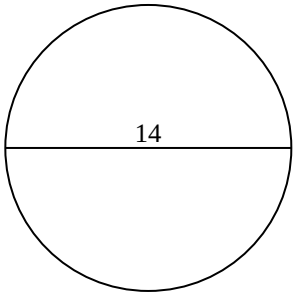

3)

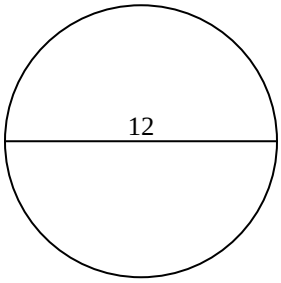

4)

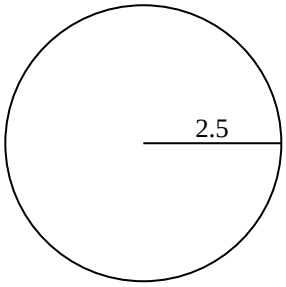

5)

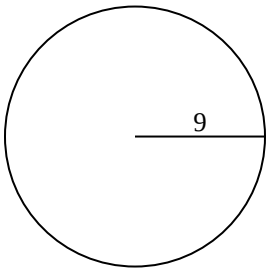

6)

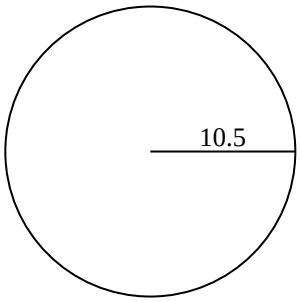

7)

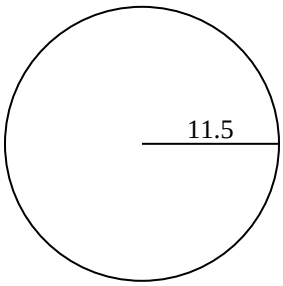

8)

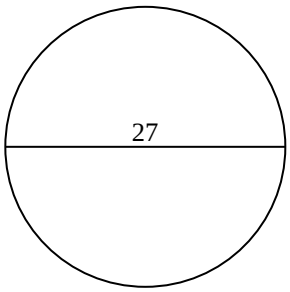

9)

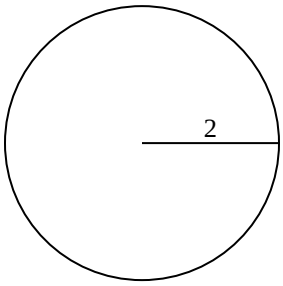

10)

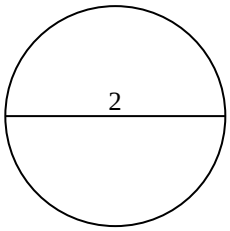

Respuestas

1.	201.1	50.3
2.	153.9	44
3.	113.1	37.7
4.	19.6	15.7
5.	254.5	56.5
6.	346.4	66
7.	415.5	72.3
8.	572.6	84.8
9.	12.6	12.6
10.	3.1	6.3

1-10	90	80	70	60	50	40	30	20	10	0

Encontrando el área y circunferencia de un círculo. Nombre:

Encuentra el área y circunferencia de cada círculo. Los círculos no están a escala.

66	254.5	50.3	572.6	37.7
72.3	12.6	19.6	113.1	153.9
15.7	346.4	56.5	201.1	84.8
415.5	12.6	44		

1)

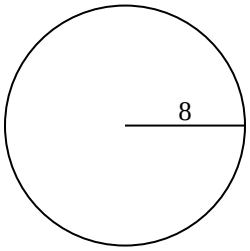

2)

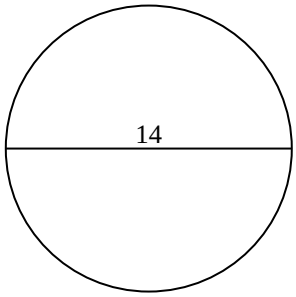

3)

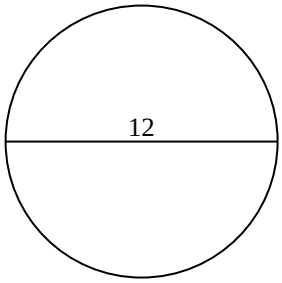

4)

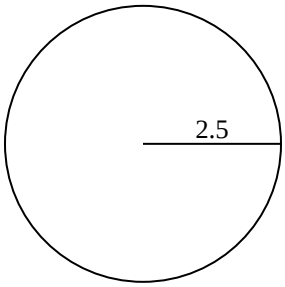

5)

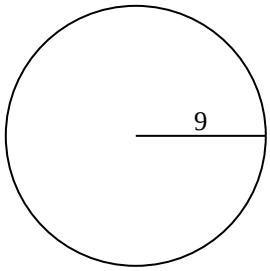

6)

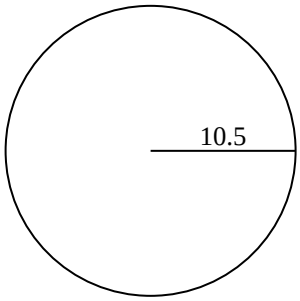

7)

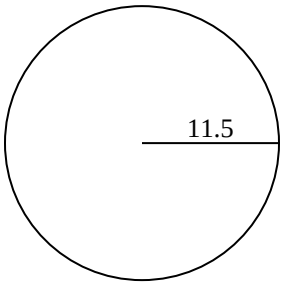

8)

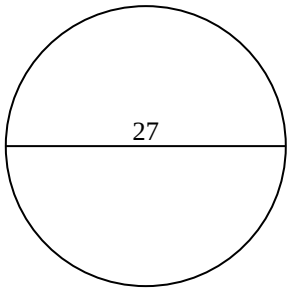

9)

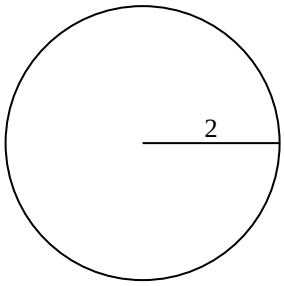

Respuestas

1. _____ _____
2. _____ _____
3. _____ _____
4. _____ _____
5. _____ _____
6. _____ _____
7. _____ _____
8. _____ _____
9. _____ _____

1-9	89	78	67	56	44	33	22	11	0