Completar y emparejar ecuaciones de volumen Nombre:

Empareje cada problema con la ecuación que podría representarlo. Responda con el término y la letra que faltan.

Ej) 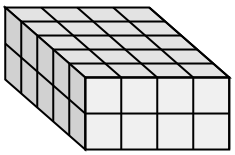

1) 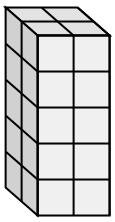

2) 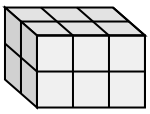

3) 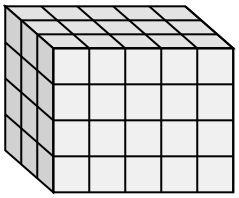

4) 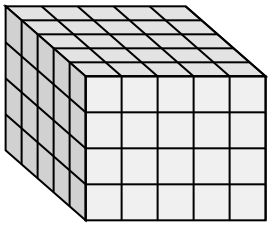

5) 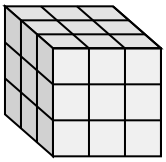

6) 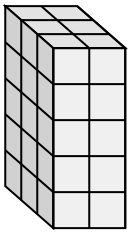

7) 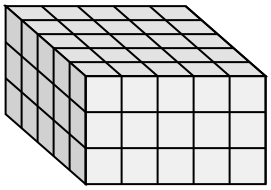

8) 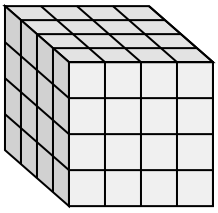

9) 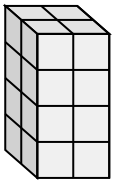

10) 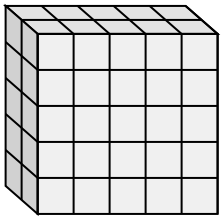

11) 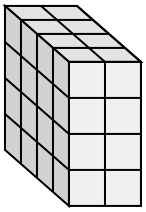

A. 5 × ___ × 4 = 100

B. 5 × 4 × ___ = 40

C. 5 × 5 × ___ = 75

D. ___ × 5 × 5 = 50

E. 3 × 5 × ___ = 60

F. 3 × 2 × 5 = ___

G. 4 × 2 × 4 = ___

H. 2 × 2 × ___ = 16

I. 2 × 3 × ___ = 12

J. 2 × 2 × 5 = ___

K. 3 × 3 × 3 = ___

L. 4 × ___ × 4 = 64

Respuestas

Ej. B , 2

1. _____

2. _____

3. _____

4. _____

5. _____

6. _____

7. _____

8. _____

9. _____

10. _____

11. _____

1-10	91	82	73	64	55	45	36	27	18	9
11	0									

Completar y emparejar ecuaciones de volumen

Nombre: **Clave De Respuestas**

Empareje cada problema con la ecuación que podría representarlo. Responda con el término y la letra que faltan.

Ej) 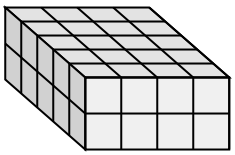

1) 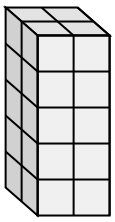

2) 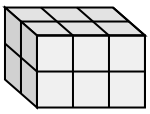

3) 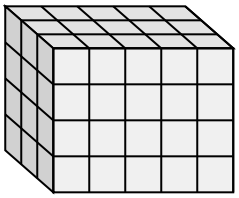

4) 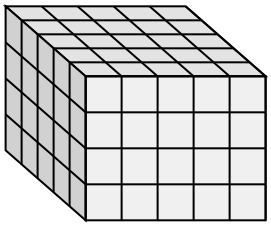

5) 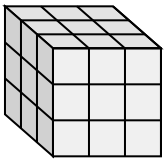

6) 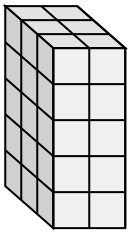

7) 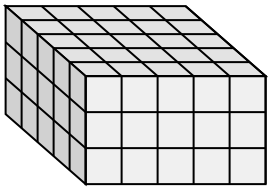

8) 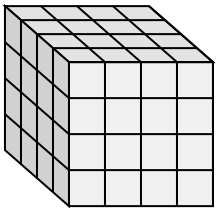

9) 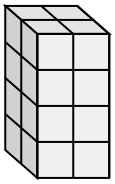

10) 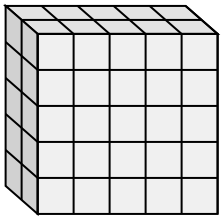

11) 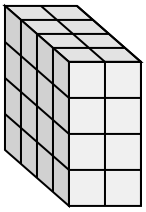

A. 5 × ___ × 4 = 100

B. 5 × 4 × ___ = 40

C. 5 × 5 × ___ = 75

D. ___ × 5 × 5 = 50

E. 3 × 5 × ___ = 60

F. 3 × 2 × 5 = ___

G. 4 × 2 × 4 = ___

H. 2 × 2 × ___ = 16

I. 2 × 3 × ___ = 12

J. 2 × 2 × 5 = ___

K. 3 × 3 × 3 = ___

L. 4 × ___ × 4 = 64

Respuestas

Ej. **B , 2**

1. **J , 20**
2. **I , 2**
3. **E , 4**
4. **A , 5**
5. **K , 27**
6. **F , 30**
7. **C , 3**
8. **L , 4**
9. **H , 4**
10. **D , 2**
11. **G , 32**

1-10	91	82	73	64	55	45	36	27	18	9
11	0									