Estimando el Peso (Anglosajón) Nombre:

Determina cuál letra mejor representa el peso del objeto.

Onza (oz)
Una onza es aproximadamente el peso de una rebanada de pan.



Libra (lb)
Uma libra é mais ou menos o peso de uma lata de vegetais.

Recordar:
Hay 16 onzas en 1 libra.

1)

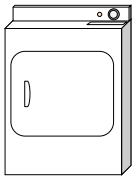

Secadora de ropa
A. 7 libras
B. 110 libras
C. 1 onza
D. 160 onzas

2)



Caballo adulto
A. 1 onza
B. 900 libras
C. 14 onzas
D. 100 libras

3)

Archivador
A. 120 libras
B. 160 onzas
C. 11 onzas
D. 2 libras

4)



Patineta
A. 33 libras
B. 0.71 onzas
C. 4 libras
D. 7 onzas

5)

Escoba
A. 440 libras
B. 20 libras
C. 2 libras
D. 4 onzas

6)

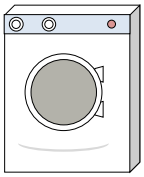

Lavadora
A. 3 toneladas
B. 16 libras
C. 165 libras
D. 0.2 onzas

7)



Elefante
A. 15 onzas
B. 11000 libras
C. 300 libras
D. 4000 onzas

8)

Rana
A. 17 onzas
B. 2 onzas
C. 2 libras
D. 11000 libras

9)



Lata de soda
A. 9 onzas
B. 100 libras
C. 4 libras
D. 0.04 onzas

Respuestas

1. _____
2. _____
3. _____
4. _____
5. _____
6. _____
7. _____
8. _____
9. _____

1-9	89	78	67	56	44	33	22	11	0

Determina cuál letra mejor representa el peso del objeto.

Onza (oz)
Una onza es aproximadamente el peso de una rebanada de pan.



Libra (lb)
Uma libra é mais ou menos o peso de uma lata de vegetais.

Recordar:
Hay 16 onzas en 1 libra.

1)

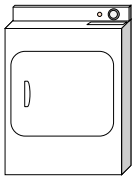

Secadora de ropa
A. 7 libras
B. 110 libras
C. 1 onza
D. 160 onzas

2)



Caballo adulto
A. 1 onza
B. 900 libras
C. 14 onzas
D. 100 libras

3)

Archivador
A. 120 libras
B. 160 onzas
C. 11 onzas
D. 2 libras

4)



Patineta
A. 33 libras
B. 0.71 onzas
C. 4 libras
D. 7 onzas

5)

Escoba
A. 440 libras
B. 20 libras
C. 2 libras
D. 4 onzas

6)

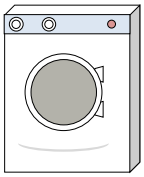

Lavadora
A. 3 toneladas
B. 16 libras
C. 165 libras
D. 0.2 onzas

7)



Elefante
A. 15 onzas
B. 11000 libras
C. 300 libras
D. 4000 onzas

8)

Rana
A. 17 onzas
B. 2 onzas
C. 2 libras
D. 11000 libras

9)



Lata de soda
A. 9 onzas
B. 100 libras
C. 4 libras
D. 0.04 onzas

Respuestas

1. B
2. B
3. A
4. C
5. C
6. C
7. B
8. B
9. A

1-9	89	78	67	56	44	33	22	11	0